Nkhskt. Angie Motshekga,
iNdvuna yeMfundvo yeSisekelo

UMnu Enver Surty, Liphini
leNdvuna yeMfundvo
yeSisekelo

Letincwadzi tekusebentela tikhicitelwe bantfwana baseNingizimu Afrika ngekuholwa yiNdvuna yeTemfundvo yeSisekelo, Nkhskt Angie Motshekga akanye neLiphini lakhe uMnu Enver Surty.

LeTincwadzi Tekusebentela takaRainbow tiyincenye yemitamo yaleLitiko leTemfundvo yeSisekelo yekutfutfukisa bafundzi baseNingizimu Afrika emabangeni ekucala lasitfupha ekufundza. Njengalomunye wemigomo lehamba embili eLuhlelweni lweKusebenta lwaHulumende, lomsebenti ukhokhelwe ngesihle Silulu seTimali saVelonkhe. Ngenca yalokusekelwa ngetimali, leLitiko leTemfundvo liphumelele kwakha letincwadzi ngato tonkhe letilwimi letisemtsetfweni kulelive.

Siyetsemba kutsi bothishela batatitfola tilusito kakhulu letincwadzi tekusebentela basafundzisa malanga onkhe kute bafundzi bakhone kucedza luhlelo lwabo lwekufundza. Setame, ngekucophelela lokukhulu, kusita thishela kuleyo naleyo ncenye yemsebenti, ngekusebentisa timphawu letititfombe kukhombisa umfundzi loko lokumele akwente.

Siyetsemba bantfwana nabo batakujabulela kusebentisa letincwadzi basachubeka nekukhula nekufundza; nekutsi bothishela batawutfokota kanye nabo.

Sifisela bothishela nebafundzi imphumelelo basachubeka nekusebentisa letincwadzi tekusebentela.

ISBN 978-1-4315-0001-7

Rainbow WORKBOOKS

MATHEMATICS IN SISWATI
GRADE 2 – BOOK 1
TERMS 1 & 2
ISBN 978-1-4315-0001-7

THIS BOOK MAY NOT BE SOLD.

1 2 3 4

Published by the Department of Basic Education
222 Struben Street
Pretoria
South Africa

© Department of Basic Education
Sixth edition 2016
Author team: Blom, L., Aitchison, J.J.W.

The Department of Basic Education has made every effort to trace copyright holders but if any have been inadvertently overlooked, the Department will be pleased to make the necessary arrangements at the first opportunity.

TIBALO NGESISWATI – Libanga 2 Incwadzi I

ISBN 978-1-4315-0001-7

Kubuyeketiwe futsi kwahlelenjiswa ngekwema-CAPS

Libanga 2

Ligama:

Likilasi:

basic education
Department:
Basic Education
REPUBLIC OF SOUTH AFRICA

TIBALO NGESISWATI

Incwadzi I
Emathemu 1 & 2

LOKUCUKETFWE

Inombolo	Sihloko	Likhasi
1	Mine nemndeni wami	2
2	Kubala	4
3	Tinombolo	6
4	Tinombolo letinye	8
5	Kuhlanganisa nekususa	10
6	Kwabelana nemali	12
7	Emaphethini	14
8	Bobunjwa	16
9	Emabhola nemabhokisi	18
10	Budze	20
11	Sisindvo	22
12	Umtsamo	2°
13	Sikhatsi	26
14	Ikhalenda Yetinsuku Tekutalwa	28
15	Gcogca uphindze uhlunge	30
16	Fundza uphindze uhumushe	32
17	Ngembili, emkhatsini nasemuva	34
18	Tinombolo 1 – 30	36
19	Imigca-nombolo	38
20	Imigca-nombolo leyengetiwe	40
21	Kuhlanganisa nekususa	42
22	Emalanga, emaviki netinyanga	44
23a	Kuhlanganisa	46
23b	Kususa	48
24	Kabanti ngekwengeta	50
25	Imali	52
26	Imali yeliphepha	54
27	Emaphethini	56
28	Lokwengetiwe ngemaphethini	58
29	Kuphindzaphindza: × 2	60
30	Kuphindzaphindza: × 5	62
31	Tindzaba ngekuphindzaphindza	64
32	Timo sakhiwo letibusontsatfu (3D)	66

Inombolo	Sihloko	Likhasi
33	Hlela ucatsanise tinombolo: 1 – 40	68
34	Hlela ucatsanise: 40 – 50	70
35	Tinombolo 40 – 50	72
36	Tikwele, bocalandze, bocalantsatfu netindilinga	74
37	Kuhlanganisa nekususa kufika ku 20	76
38	Kuhlanganisa nekususa kufika ku 50	78
39a	Kuhlanganisa lokwengetiwe	80
39b	Kuhlanganisa lokwengetiwe (kuyachutjekiswa)	82
40	Budze	84
41	Kususa (kuyachutjekiswa)	86
42a	Lokunye ngekususa	88
42b	Lokwengetiwe ngekunciphisa	90
43	Kwesindza nebumalula	92
44	Emaphethini etinombolo: ngakubili	94
45	Kuphindza kabili	96
46	Phindza kabili futsi	98
47	Phindza kabili	100
48	Phindza kabili: siyachubeka	102
49	Kwekuphatsa nemtsamo	104
50	Kuphindzaphindza: × 3	106
51	Emaphethini etinombolo: ngakutsatfu	108
52	Kuphindzaphindza: × 4	110
53	Emaphethini etinombolo: Ngakune	112
54	Tindzaba ngekuphindzaphindza	114
55	Ema-awa	116
56	Emaphethini etinombolo: ngesihlanu	118
57a	Imizuzu	120
57b	Siyachubeka ngemizuzu	122
58	Kubeka ngemacembu nekwabelana	124
59	Siyachubeka nekubutsanisa nekwaba	126
60	Asichubeke nekubutsanisa nekwaba	128
61	Kubutsanisa nekwabelana	130
62	Bohhafu: 1 – 20	132
63	Kwabelana 20 – 50	134
64	Imininingwane	136
	Lokujutjiwe 1	
	Lokujutjiwe 2	

1 – 200

1	2	3	4	5	6	7	8	9	10
11	12	13	14	15	16	17	18	19	20
21	22	23	24	25	26	27	28	29	30
31	32	33	34	35	36	37	38	39	40
41	42	43	44	45	46	47	48	49	50
51	52	53	54	55	56	57	58	59	60
61	62	63	64	65	66	67	68	69	70
71	72	73	74	75	76	77	78	79	80
81	82	83	84	85	86	87	88	89	90
91	92	93	94	95	96	97	98	99	100
101	102	103	104	105	106	107	108	109	110
111	112	113	114	115	116	117	118	119	120
121	122	123	124	125	126	127	128	129	130
131	132	133	134	135	136	137	138	139	140
141	142	143	144	145	146	147	148	149	150
151	152	153	154	155	156	157	158	159	160
161	162	163	164	165	166	167	168	169	170
171	172	173	174	175	176	177	178	179	180
181	182	183	184	185	186	187	188	189	190
191	192	193	194	195	196	197	198	199	200

Libanga 2

Rainbow WORKBOOKS

Tibalo

NGESISWATI

Lencwadzi ya:

SISWATI

Incwadzi 1

Lusuku:

Mine nemndeni wami

Ngineminyaka lesiphohlongo.

Inombolo yendlu yakitsi ngu 12.

Ngingulomncane emndenini wakitsi.

Nginabosisi lababili.

Babe wami uneminyaka lengu 32.

1 Gcwalisa timphendvulo kulemibuto ngawe nangemndeni wakho.

Ligama lami ngu_____ .

Ngineminyaka le _____ .

Eminyakeni lemibili leyendlulile bengineminyaka le_____ .

Emnyakeni lotako ngitawuba neminyaka le_____ .

Ngihlala e_____ .

Ngubani lomdzala emndenini wakho?_____

Bhala phasi kutsi uneminyaka lemingakhi. _____ .

Ngubani lomncane emndenini wakini?_____

Bhala phasi kutsi uneminyaka lemingakhi _____ .

Namuhla ngumhlaka_____ .

Dvweba sitfombe semndeni wakho.

1 2 3 4 5 6 7 8 9

Teacher:
Sign:
Date:

11 12 13 14 15 16 17 18 19 20

Lusuku:

Kubala

Gcwalisa tikhala letingenalutfo.



emehlo

emacashata

ticeshana

	2
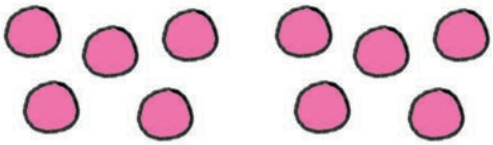	
	



emehlo

emacashata

ticeshana

emehlo

emacashata

ticeshana

emehlo

emacashata

ticeshana

Yaba lamacashata neticeshana ngalokulinganako.

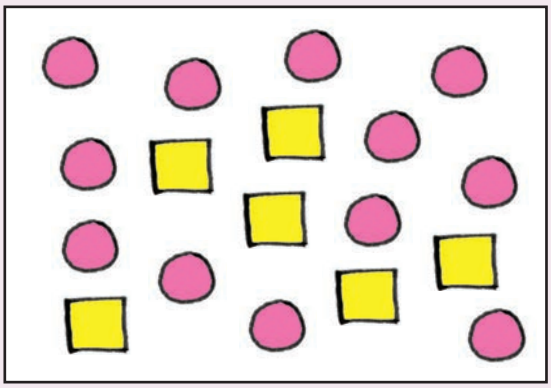





Teacher:

Sign:

Date:

11 12 13 14 15 16 17 18 19 20

Lusuku:

Tinombolo

Fundza letimphawu tetinombolo kanye nemagama ebhodini.

1 73 59 imfica lishumi nakunye

66 35 lishumi nakune kune

42 97 lishumi nesikhombisa

24 32 sitfupha lishumi

lishumi nemfica

Bhala linani lemabhaluni esibayeni.

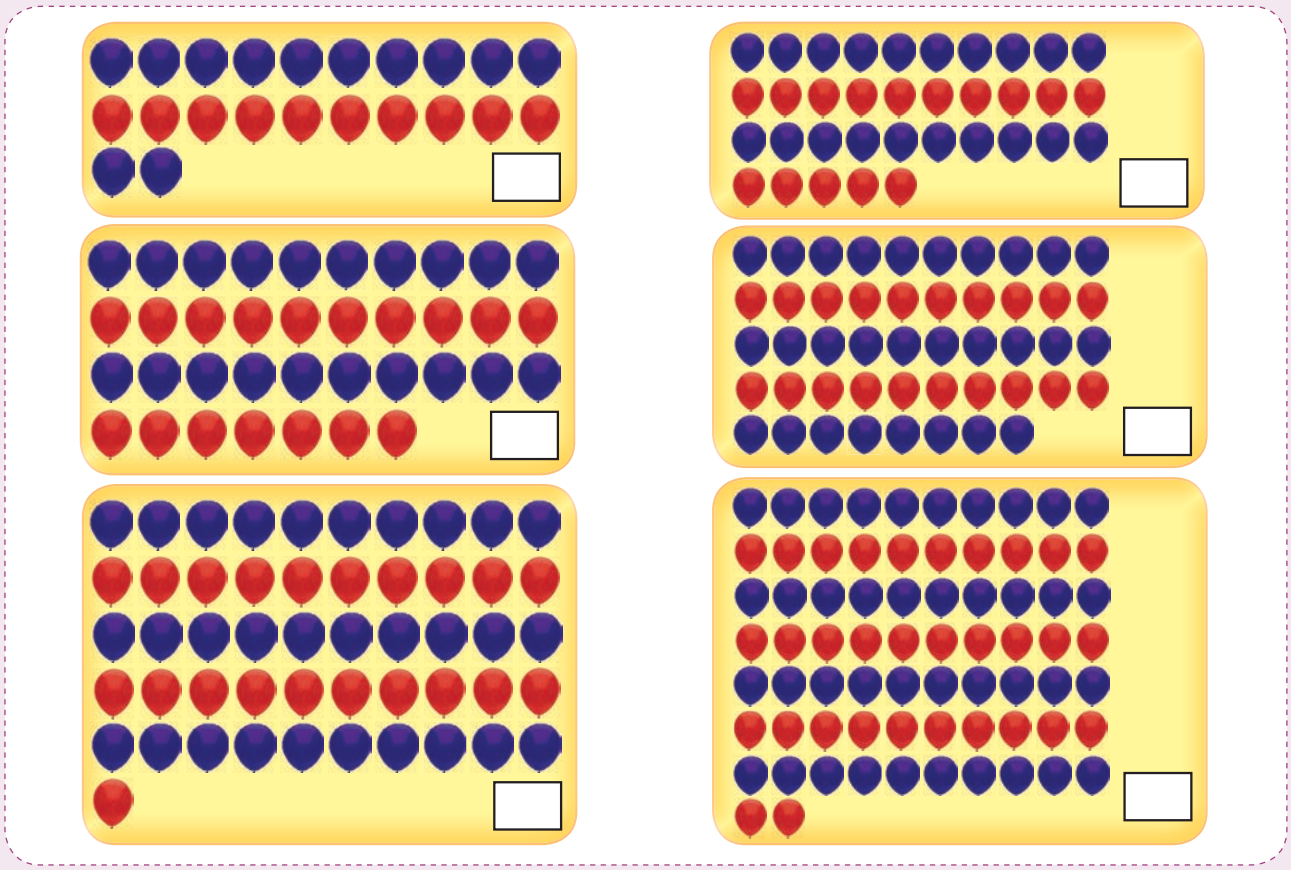

1 2 3 4 5 6 7 8 9 10

Bhala letinombolo letilandzelako ngemagama.

6	_____	12	_____
4	_____	17	_____
8	_____	14	_____
1	_____	22	_____
2	_____	18	_____
5	_____	11	_____
0	_____	20	_____
10	_____	15	_____
3	_____	13	_____
9	_____	16	_____

37 38 39 40 41 42 43 44

89 90 91 92 93 94 95 96

Teacher:
Sign:
Date:

11 12 13 14 15 16 17 18 19 20

Lusuku:

Tinombolo letinye



Dvweba △ etinombolweni leticondzile na ○ etinombolweni lugweje.

leticondzile

lugweje

1	2	3	4	5	6	7	8	9	10
11	12	13	14	15	16	17	18	19	20

Faka tinombolo kuletindlu.

Bala lemibala lemibili yebuhlalu.



Bhala inombolo yelinani ngalinye.

10 2 = 12

10 3 = ☐

10 5 = ☐

10 8 = ☐

10 9 = ☐

Singayibhala kanje.

10 + 2 = 12

☐ + ☐ = ☐

☐ + ☐ = ☐

☐ + ☐ = ☐

☐ + ☐ = ☐

Itsini imphendvulo?

10 + 1 = ☐	10 + 9 = ☐	10 + 6 = ☐
10 + 8 = ☐	10 + 2 = ☐	10 + 3 = ☐
10 + 5 = ☐	10 + 4 = ☐	10 + 7 = ☐

1 3 5 7 9 11 13 15 17 19

2 4 6 8 10 12 14 16 18 20

Teacher:
Sign:
Date:

11 12 13 14 15 16 17 18 19 20

Lusuku:

Kuhlanganisa nekususa



Hlanganisa uphindze ususe.

9 + 8 = 17



18 – 8 = ☐

☐ + ☐ = ☐

☐ + ☐ = ☐

☐ + ☐ = ☐

Bala.

6 + 5 = ☐	8 + 9 = ☐	11 + 3 = ☐	12 – 5 = ☐
8 + 7 = ☐	3 + 8 = ☐	9 – 5 = ☐	16 – 9 = ☐
6 + 4 = ☐	8 + 4 = ☐	8 – 4 = ☐	6 – 4 = ☐

Hlanganisa.

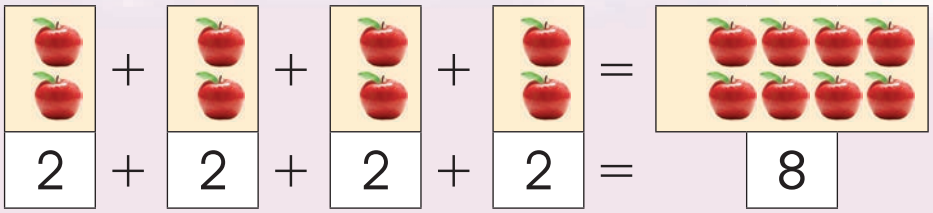

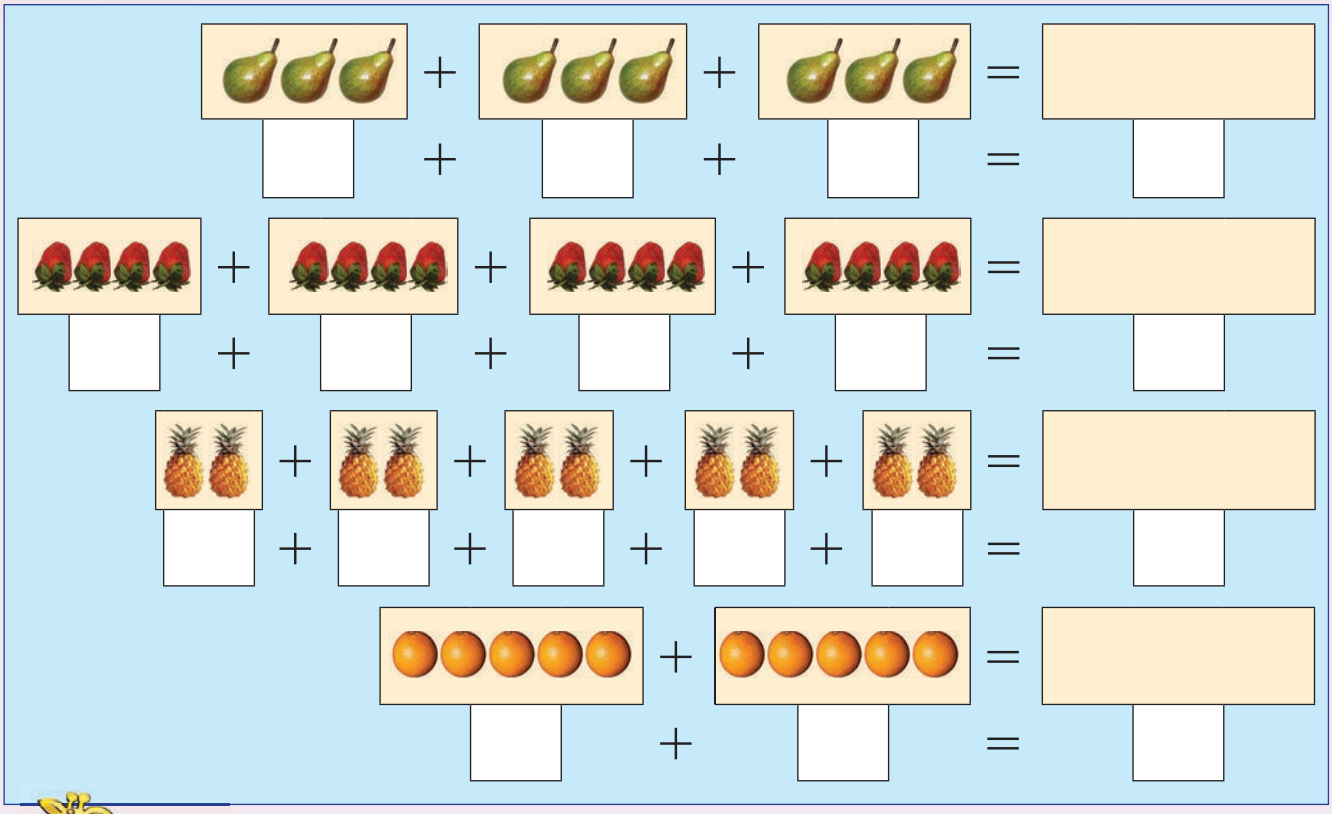

Bala.

2 + 2 + 2 = ☐	1 + 1 + 1 + 1 + 1 + 1 = ☐	2 + 2 + 2 + 2 = ☐
4 + 4 = ☐	3 + 3 + 3 + 3 = ☐	4 + 4 + 4 + 4 = ☐
5 + 5 + 5 = ☐	5 + 5 = ☐	1 + 1 + 1 = ☐

2 + 2 + 2 + 2 + 2 + 2

Teacher:
Sign:
Date:

11 12 13 14 15 16 17 18 19 20

Lusuku:

Kwabelana nemali

Yaba letitselo ngekulingana.

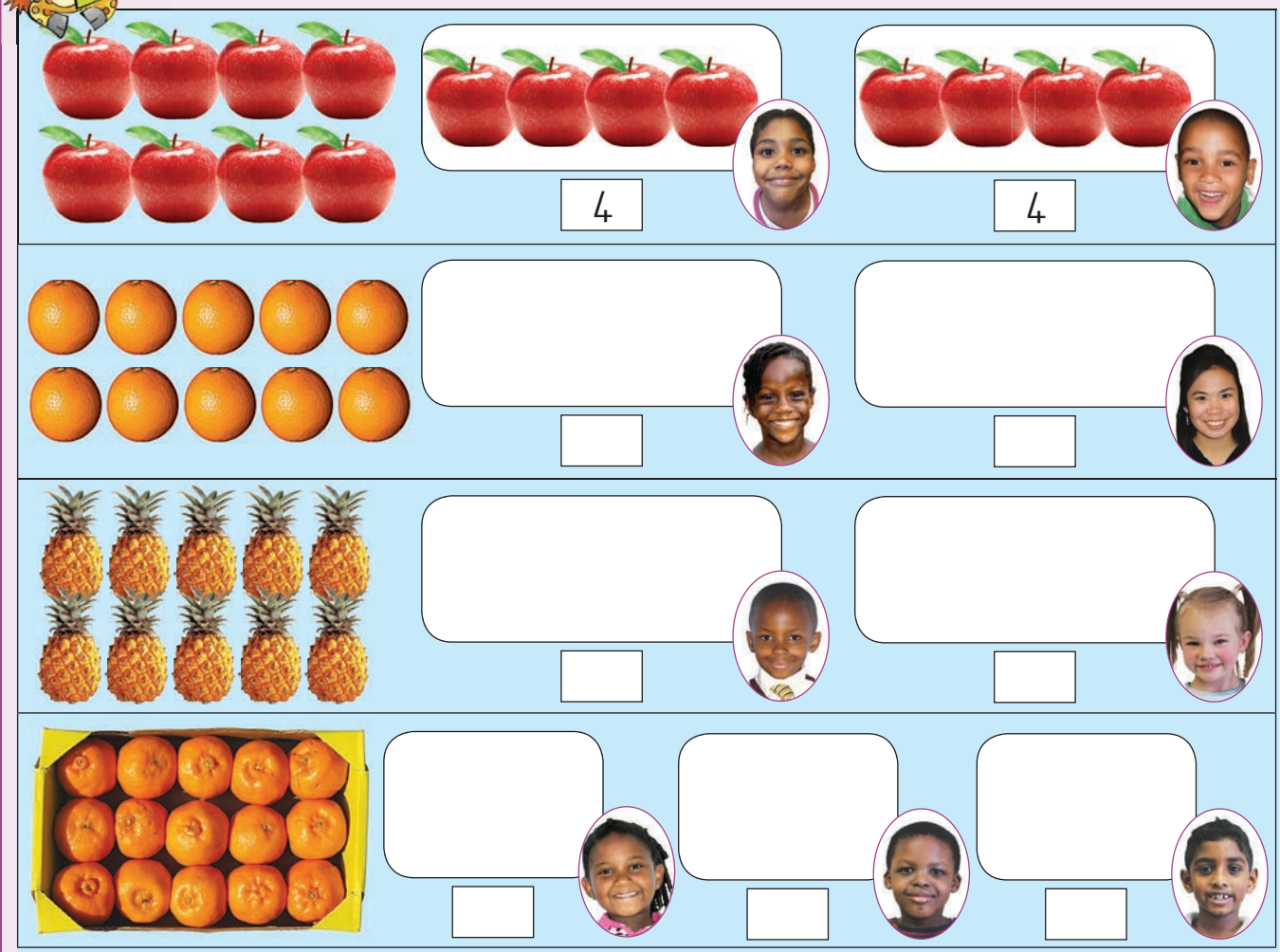



Cedzela.

senti munye			

Faka umbala emalini yensimbi noma yeliphepha lefanele kute nawuhlanganisa kuphume linani lelilingana nemali yensimbi noma yeliphepha lesekucaleni kweluhele ngalunye.

=	10c	10c	5c	2c	1c	2c

=	5c	2c	2c	1c	2c	2c

=	R2	R2	R1	R1	R1

=	R5	R2	R1	R5	R1	R2

=	R2	R2	R5	R5	R2	R1	R5

R1 1c R5 5c R10

Teacher:
Sign:
Date:

11 12 13 14 15 16 17 18 19 20

Lusuku:

Emaphethini

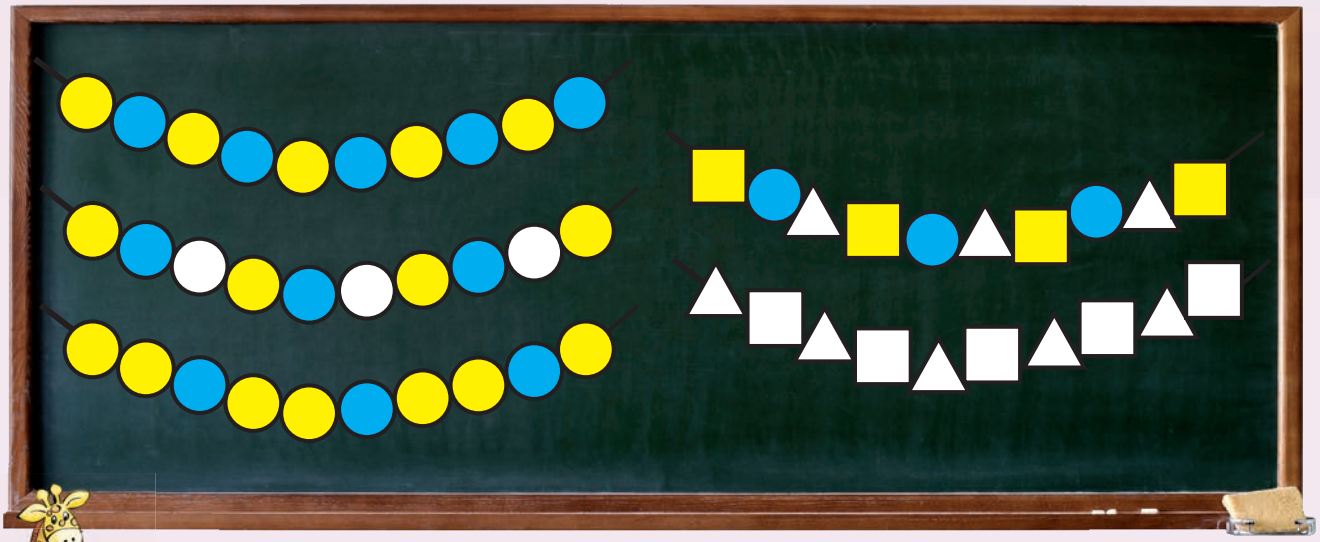

Tsatsisa lamaphethini lasebhodini uwakopele kuletikhala ngentasi.



Khulisa lephethini.

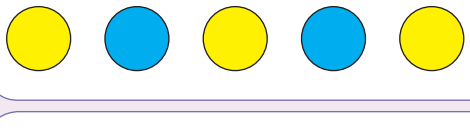

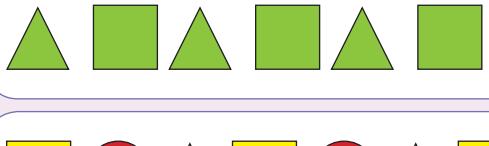



Faka umbala kulobuhlalu ngalesikhatsi ubala ngakubili.

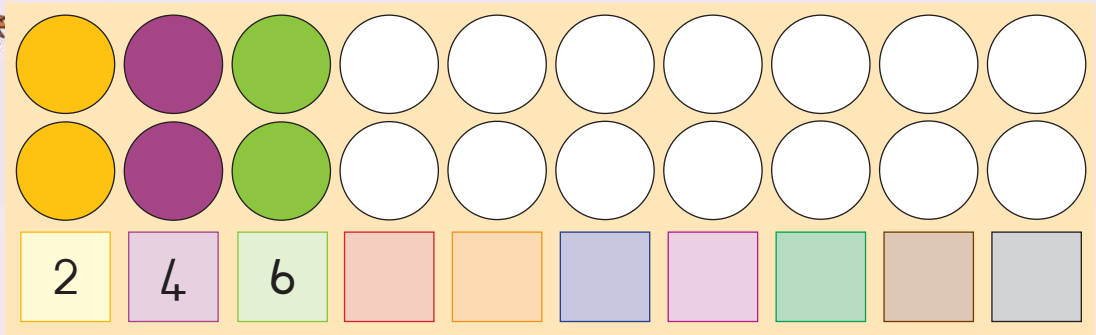

Faka umbala kuletibaya ngalesikhatsi ubala ngakuhlanu.

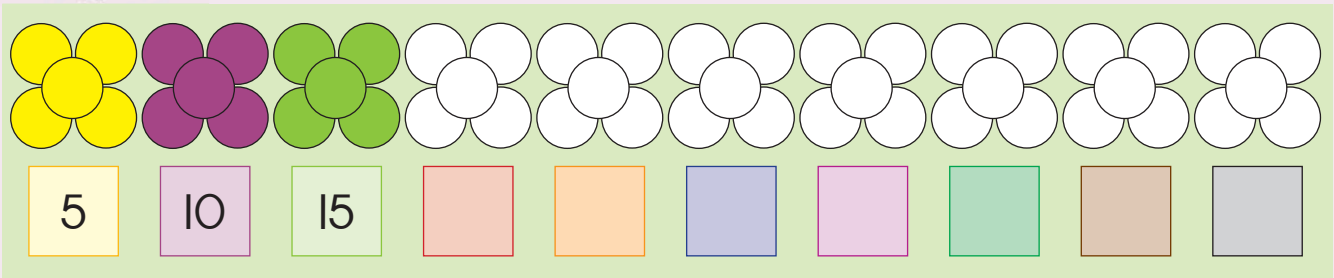

Faka umbala kulobuhlalu ngalesikhatsi ubala ngemashumi.

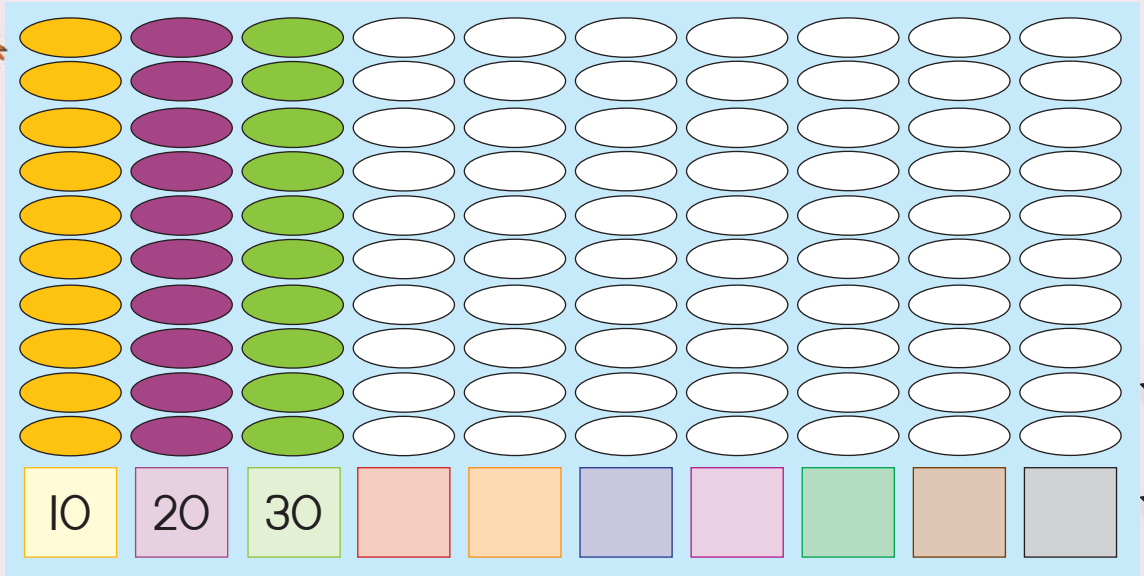

Teacher:
Sign:
Date:

Lusuku:

Bobunjwa



1 Faka umbala lolingangane kubocalandze, letindilinga tibe bovu bese kutsi bocalantsatfu babe mtfubi.

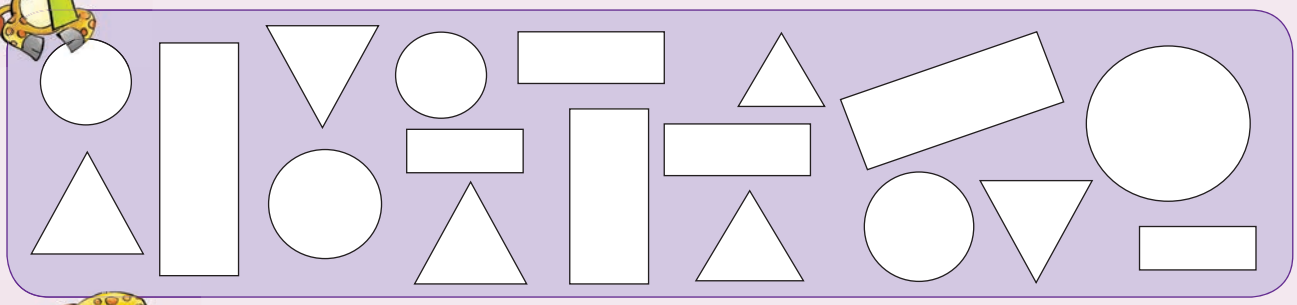

2 Faka umbala lobovu kuto tonkhe tindilinga letinkhulu, bocalandze babe lingangane kantsi bocalantsatfu labancane babe mtfubi.

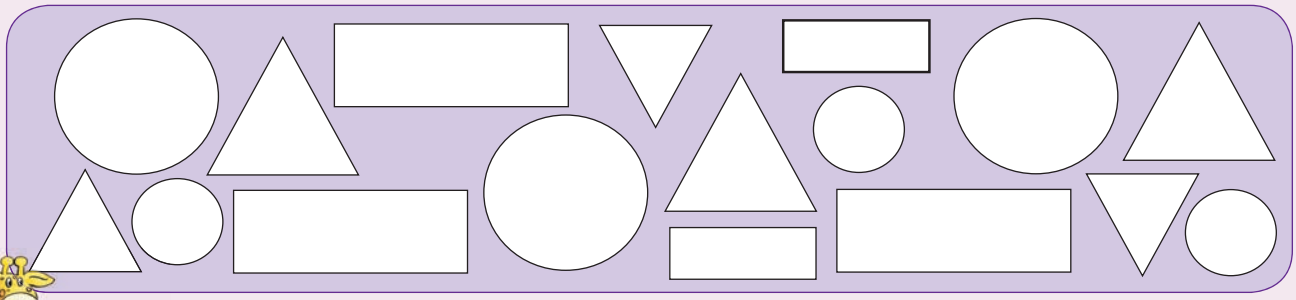

3 Emacala acondzile noma ayindilinga? Faka umbala kumphendvulo leliciniso.



kucondzile | yindilinga

kucondzile | yindilinga



kucondzile | yindilinga

Dvweba kulamanye emacala emavivane.

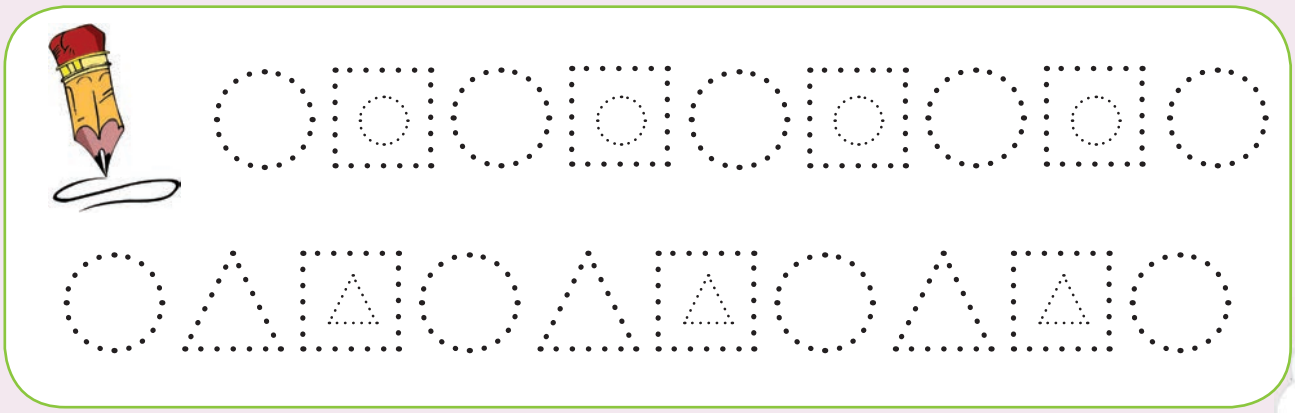

Teacher:
Sign:
Date:

Lusuku:

Emabhola nemabhokisi

1 Biyela emabhokisi ngembala lolingangane bese emabhola kuba ngulobovu.

2 Faka umbala emphendvulweni leliciniso.

Libhokisi	liyashelela	liyagicika



Ibhola	iyashelela	iyagicika

3 Faka umbala kumphendvulo leliciniso.

umphetfo loyindilinga

umphetfo locondzile

umphetfo loyindilinga

umphetfo locondzile

umphetfo loyindilinga

umphetfo locondzile

umphetfo loyindilinga

umphetfo locondzile



umphetfo loyindilinga

umphetfo locondzile

umphetfo loyindilinga

umphetfo locondzile

umphetfo loyindilinga

umphetfo locondzile

umphetfo loyindilinga

umphetfo locondzile

4 Shano kutsi ibhola ingemuva, ingaphambili, isedvute ne nobe ingetulu kwelibhokisi.

phambili | ngemuva

ngetulu | edvute ne

phambili | ngemuva

ngetulu | edvute ne

phambili | ngemuva

ngetulu | edvute ne

phambili | ngemuva

ngetulu | edvute ne

ibhola libhokisi

Teacher:

Sign:

Date:

11 12 13 14 15 16 17 18 19 20

Lusuku:

Budze

Bentani laba?



Ngusiphi sitimela lesifisha nobe lesidze?



sifisha | sidze



sifisha | sidze

Ngusiphi sakhiwo lesiphakeme nobe lesiphasi?

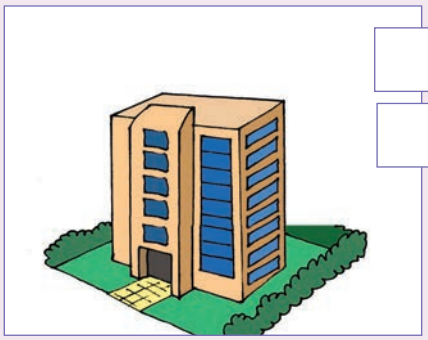

siphakeme

siphasi

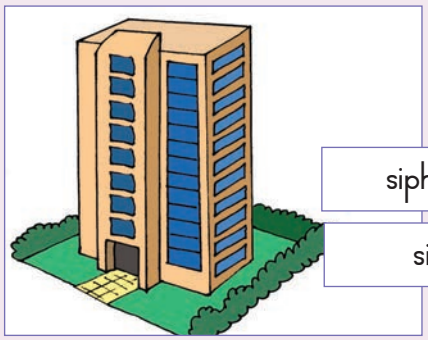

siphakeme

siphasi

3 Ngumuphi umuntfu lomfisha nobe lomudze?

mfisha	mfisha
mudze	mudze

4 Sebentisa lomfanekiso wesandla kuLokujutjiwe I. Ngabe localandze mudze ngetandla letingakhi? Sebentisa lomfanekiso welunyawo kuLokujutjiwe I. Ngabe localandze mudze ngetinyawo letingakhi?

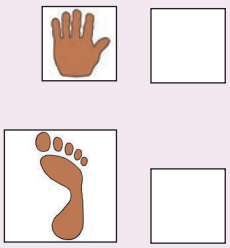

5 Nyalo linganisa lokuya etulu kwacalandze ngetandla nangetinyawo.

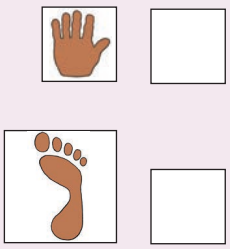



Teacher:
Sign:
Date:

11 12 13 14 15 16 17 18 19 20

Lusuku:

Sisindvo



Shano kutsi lentfo ngabe iyesindza noma imelula kunalena lenye.

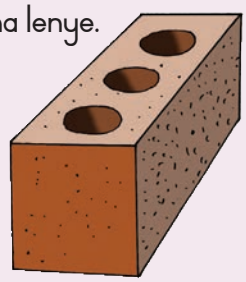

iyesindza	imalula	iyesindza	imalula

Biyela intfo leyesindzako.





Ngabe lentfo yesindza ngetulu nobe ngaphasi kwelikhilogramu linye?



iyesindza | imalula

iyesindza | imalula

iyesindza | imalula

iyesindza | imalula

iyesindza imalula

Teacher:
Sign:
Date:

11 12 13 14 15 16 17 18 19 20

Lusuku:

Umtsamo

Cocani ngalesitfombe.

Faka umbala emphendvulweni leliciniso.

ligcwele	alinalutfo	liyihhafu

ligcwele	alinalutfo	liyihhafu

ligcwele	alinalutfo	liyihhafu

ligcwele	alinalutfo	liyihhafu

ligcwele	alinalutfo	liyihhafu

ligcwele	alinalutfo	liyihhafu

Sikali sinye sigcwalisa sifike kumugca wekucala kulelijeke.
Tingakhi tikali letitawugcwalisa lelijeke?



Tingakhi tikali letitselwa kulamajeke?



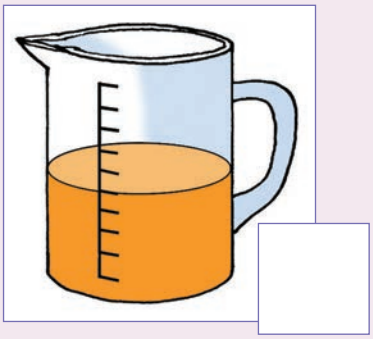

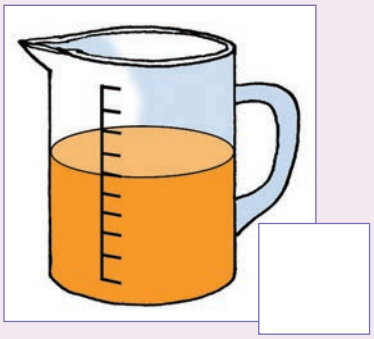

Lijeke lelingesancele libamba I litha wejusi.
Nguliphi lijeke lelinejusi lelinganako nalengesancele futsi nguliphi lelinejusi lencane?



lelinganako	lencane

lelinganako	lencane

ligcwele dlindlutfo

Teacher:
Sign:
Date:

11 12 13 14 15 16 17 18 19 20

Lusuku:

Sikhatsi

1 Yani kuLokujutjwako I. Sika emagama uwanamatsisele ngaphansi kwetitfombe kukhombisa sikhatsi selusuku.



2 Cedzela lemisho.

Ngi_____ ekuseni kakhulu.

Ngi _____ekuseni.

Ngi_____emini.

Ngi_____ onkhe malanga.

Ngi_____ kamuva onkhe malanga.

1 2 3 4 5 6 7 8 9 10



Itolo	Namuhla	Kusasa

3 Phendvula lemibuto.

Wentani umntfwana namuhla? _____

Yini leyentiwe ngumntfwana itolo? _____

Yini letawentiwa ngumntfwana kusasa? _____

4 Dvweba sitfombe sakho.

Itolo	Namuhla	Kusasa

Itolo

Teacher:
Sign:
Date:

Lusuku:

Ikhalenda Yetinsuku Tekutalwa

1 Landzelela letinyanga.

Bhimbidvwane
Sipho
Maryke
Annie

iNdlovana
Jeffrey
Simon

iNdlovulenkhulu
Sam
Juan

Mabasa
Betty
Liezel

iNkhwekhweti
Lettie
Ricco
George

iNhlaba
Mpho

Kholwane
Palesa
Lisa
Kayla

iNgci
Mbali
Brenda
Mary

iNyoni
John

iMphala
Karin
Jaco

Lweti
Gugu
Dian

iNgongoni
Kara
Richard
Denise

1 2 3 4 5 6 7 8 9 10

Bhala ligama lemntfwna ngamunye ekilasini ngalolusuku lwekutalwa kukhalenda.

Bhimbidvwane	iNdlovana	iNdlovulenkhulu
Mabasa	iNkhwekhweti	iNhlaba
Kholwane	iNgci	iNyoni
iMphala	Lweti	iNgongoni

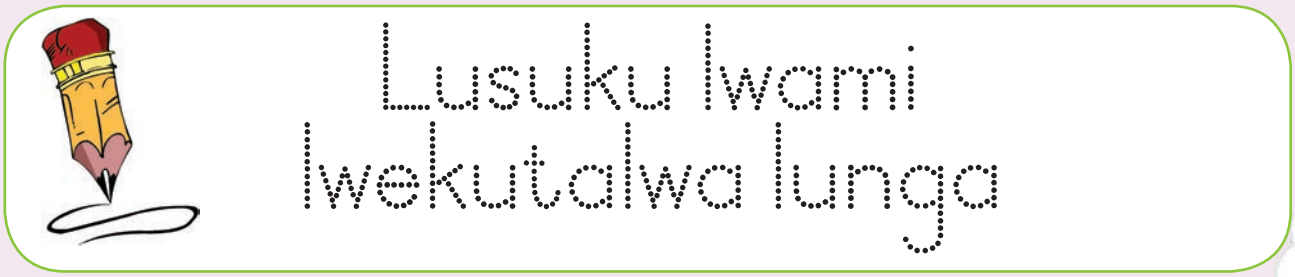

Teacher:
Sign:
Date:

11 12 13 14 15 16 17 18 19 20

Lusuku:

Gcogca uphindze uhlunge



Gcogca uphindze uhlunge emabhola bese uwadvweba ebhokisini lelifanele.

emabhola laluhlata	emabhola labovu	emabhola lalingangane	emabhola lamtfubi

Gcogca timbali bese uyatihlunga.

timbali letimtfubi	timbali letibovu	timbali letisamsobo	timbali letiphinki	timbali letiliphuti

Hlunga letintfo. Yenta imidvwebo yato.



tintfo letilula

tintfo letisindzako



emabhola lamancane

emabhola lamakhulu

emabhokisi lamancane

emabhokisi lamakhulu

Teacher:

Sign:

Date:

11 12 13 14 15 16 17 18 19 20

Lusuku:

Fundza uphindze uhumushe



Umdvwebo wami



Hlukanisa emakhrayoni. Yenta umdvwebo wawo.



Hlukanisa timbali. Yenta umdvwebo wato.

Hlukanisa lamafu nalemishi-yenkhosatana. Yenta umdvwebo wako.

Phendvula lemibuto.

bocalantsatfu	bocalandze	tindilinga

Bangakhi bocalantsatfu labalapho? _____

Bangakhi bocalandze labalapho? _____

Tingakhi tindilinga letilapho? _____

Ngabe kunabocalantsatfu labanyenti nobe bocalandze? _____

Ngabe kunetindilinga letinyenti nobe bocalantsatfu? _____

Ngabe kunetindilinga letinyenti nobe bocalandze? _____

akunalutfo	yihhafu	kugcwele

Mangakhi emajeke langenalutfo lakhona? _____

Mangakhi emajeke lagcwele ngahhafu? _____

Mangakhi emajeke lagcwele? _____

Teacher:
Sign:
Date:

11 12 13 14 15 16 17 18 19 20

Lusuku:

Ngembili, emkhatsini nasemuva

1 Chaza tinombolo ngekusebentisa emagama ngembili, emkhatsini nasemuva.

1	2	3	4	5	6	7	8	9	10	11	12	13	14	15	16	17	18	19	20	21	22	23	24	25

Sibonelo: Nguleyobhola lebovu isemkhatsini wemabhola lamabili lalingangane.



2 Bhala inombolo lefanele esikweleni.

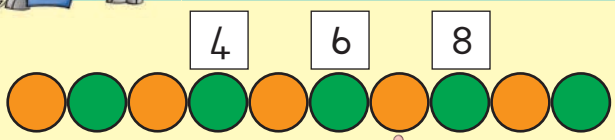

ngembili emkhatsini emuva

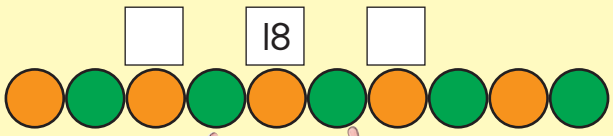

ngembili emkhatsini emuva

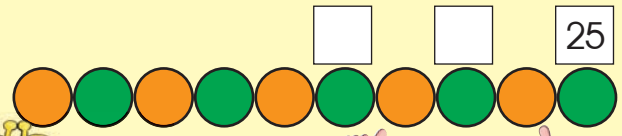

ngembili emkhatsini emuva

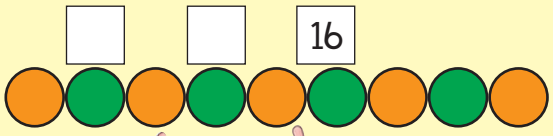

ngembili emkhatsini emuva

3 Gcwalisa tinombolo letingekho.

	2			5	
	12			15	
13			16		

10			13		
	17			20	
20					25

Nguyiphi inombolo lesembi kwa 8? _____

Nguyiphi inombolo lesemuva kwa 16? _____

Ngutiphi tinombolo letisemkhatsini wa 8 na 12? _____

4 Faka umbala lolingangane etinombolweni letisemkhatsini wa 14 na 17. Faka umbala lobovu kunombolo lesembi kwa 14 na 17. Faka umbala lomtfubi ngemuva kwa 17.

11	12	13	14	15	16	17	18	19	20

5

11 12 13 14 15 16 17 18 19 20 21 22 23 24 25 26 27 28 29 30

Bhala tonkhe letinombolo etukwebuhlalu lobumtfubi.
Sitibita ngani letinombolo letikubuhlalu lobumtfubi?

_____

Bhala tonkhe letinombolo etukwebuhlalu lobuphinki.
Sitibita ngani letinombolo letikubuhlalu lobuphinki?

_____

Yaba lobuhlalu lobumtfubi emkhatsini webantfwana labagcoke umbala lomtfubi.

Ngabe munye utfola bungakhi buhlalu? _____ . Ngabe bukhona lobusele? _____ .

Yaba buhlalu lobuphinki emkhatsini webantfwana labagcoke lokuphinki.

Ngabe munye utfola bungakhi buhlalu? _____ . Ngabe bukhona lobusele? _____ .

6 Phendvula lemibuto lelandzelako.

Bhala batsatfu bonombolo lingana labeta nje ngemuva kwa 12? _____.

Bhala batsatfu bonombolo lugweje labeta nje ngemuva kwa 14? _____.

Ngutiphi tinombolo lugweje letisemkhatsini kwa 18 na 24? _____.

Bhala phasi tinombolo lingana emkhatsini kwa 8 na 18? _____.

Teacher:
Sign:
Date:

11 12 13 14 15 16 17 18 19 20

Lusuku:

Tinombolo 1 – 30

Mangakhi emabhuku lowabalako? Mangakhi emajeke apende?



1 Bungakhi buhlalu lobubalako?

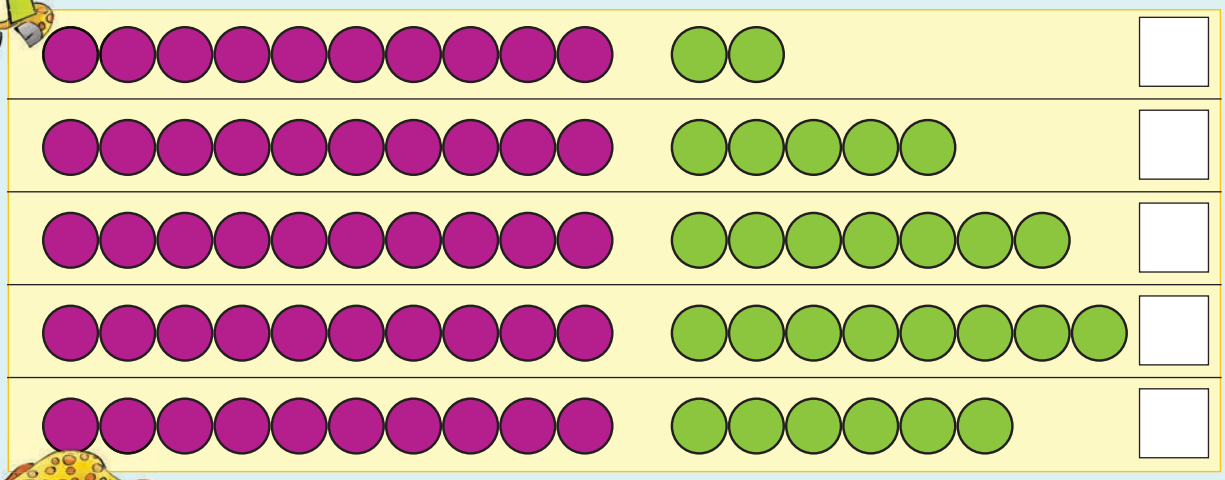

2 Mangakhi emabhuku lowabalako?



3 Gcwalisa tinombolo letingekho.

14	12	15	17	19	13	26	28	21	30
10 4	2	10	7	10					

1 2 3 4 5 6 7 8 9 10



Buka sibonelo sekucala bese ucedzela konkhe lokulandzelako.

18	=	1	lishumi	+	8	emayunithi	nobe	18	=	10	+	8
15	=		lishumi	+		emayunithi	nobe		=		+	
19	=		lishumi	+		emayunithi	nobe		=		+	
22	=		lishumi	+		emayunithi	nobe		=		+	
24	=		lishumi	+		emayunithi	nobe		=		+	



Bungakhi buhlalu lobubalako?

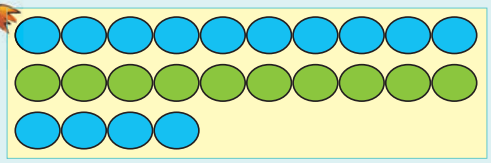

Inombolo

Singayibhala njenga: 20 + ___ = 24

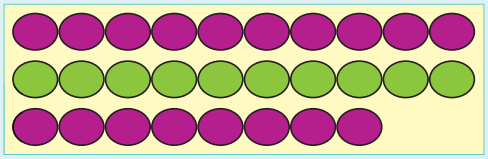

Inombolo

Singayibhala njenga: 20 + ___ = 28

Bhala emagama aletinombolo:

10	_____	11	_____
12	_____	13	_____
14	_____	15	_____
16	_____	17	_____
18	_____	19	_____
20	_____	21	_____
22	_____	23	_____
24	_____	25	_____

Buka sibonelo sekucala bese ucedzela konkhe lokulandzelako.

25	=	2	lishumi	+	5	emayunithi	22	=	2	lishumi	+	2	emayunithi
13	=		lishumi	+		emayunithi	21	=		lishumi	+		emayunithi
26	=		lishumi	+		emayunithi	19	=		lishumi	+		emayunithi

Teacher:
Sign:
Date:

11 12 13 14 15 16 17 18 19 20

Lusuku:

Imigca-nombolo

1 Gcwalisa tinombolo letingekho.

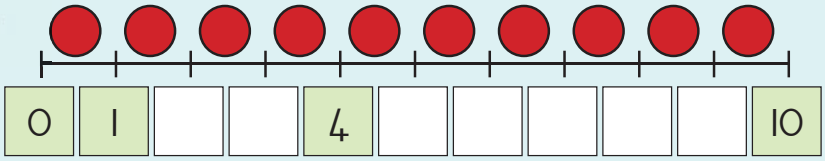

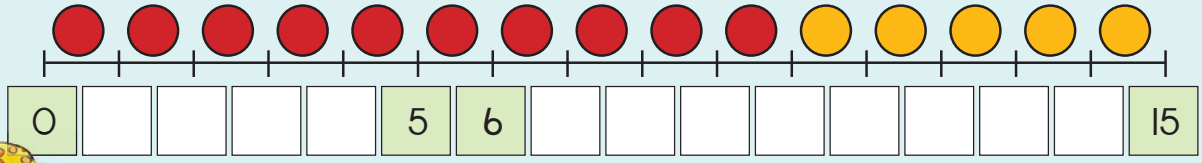

2 Ngabe logwaja uzube ngakanani? Sebentisa umugca-nombolo kutfola timphendvulo.

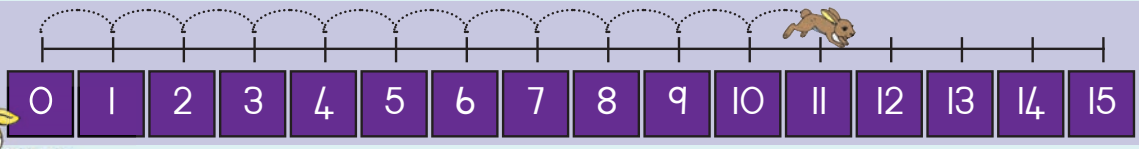

3 Ngabe imphala izube ngakanani? Sebentisa umugca-nombolo kutfola timphendvulo.

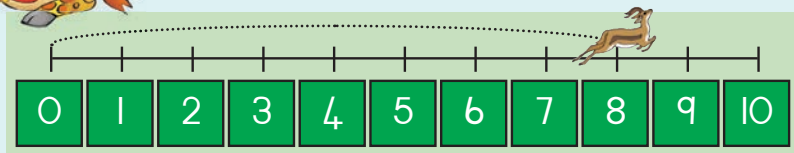

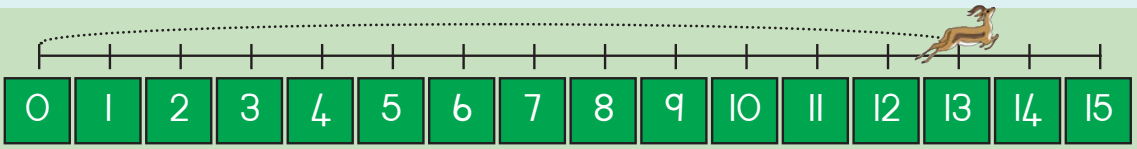

Ngabe logwaja uzube ngakanani?
Sebentisa umugca-nombolo kutfola timphendvulo.

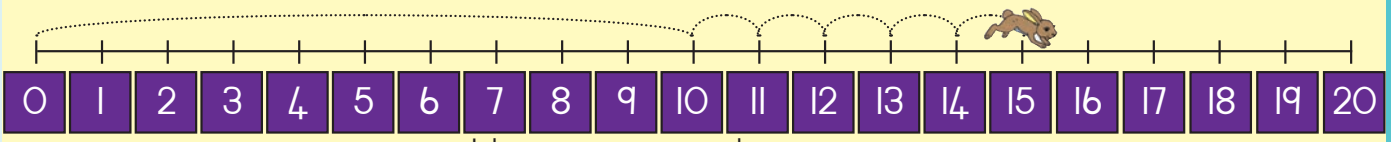

lishumi emayunithi

10 + 5 = ☐

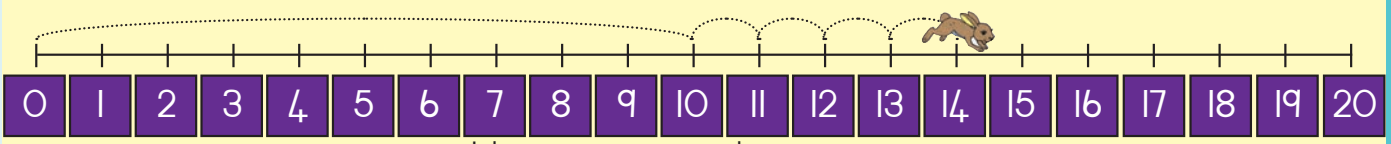

lishumi emayunithi

☐ + ☐ = ☐

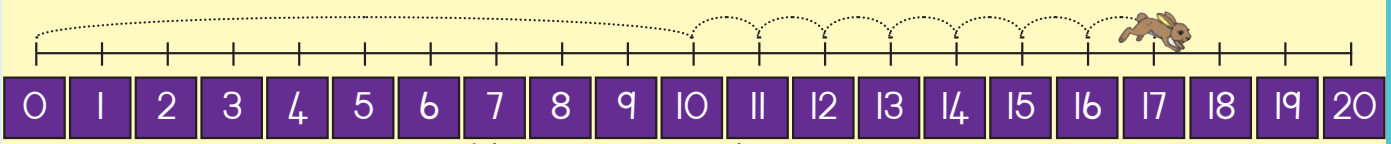

lishumi emayunithi

☐ + ☐ = ☐

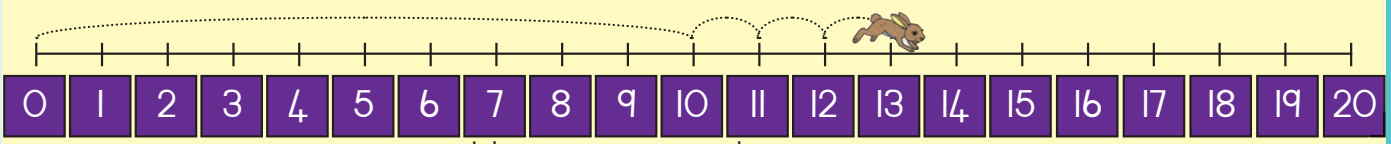

lishumi emayunithi

☐ + ☐ = ☐

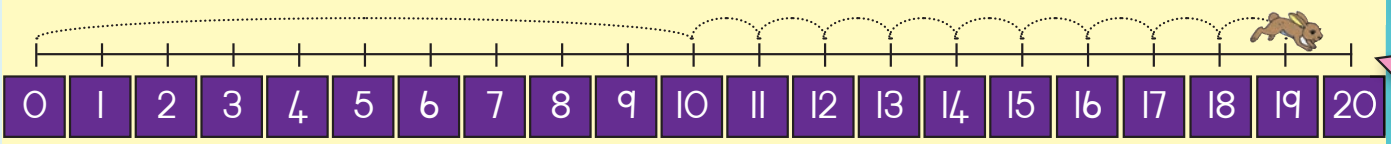

lishumi emayunithi

☐ + ☐ = ☐

Teacher:
Sign:
Date:

11 12 13 14 15 16 17 18 19 20

Lusuku:

Imigca-nombolo leyengetiwe



1 Sita logwaja kubhala sibalo. Sebentisa umugca-nombolo kutfola timphendvulo.

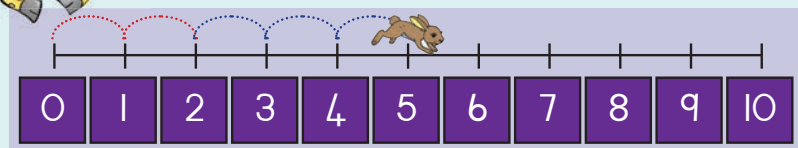

2 + 3 = 5

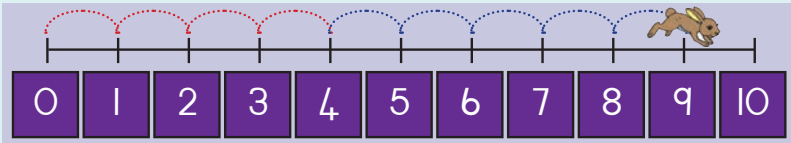

__ + __ = __

2 Sita imphala kubhala sibalo. Sebentisa umugca-nombolo kutfola timphendvulo.

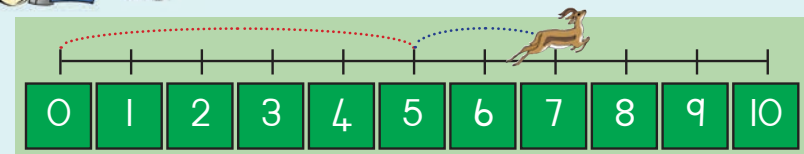

__ + __ = __

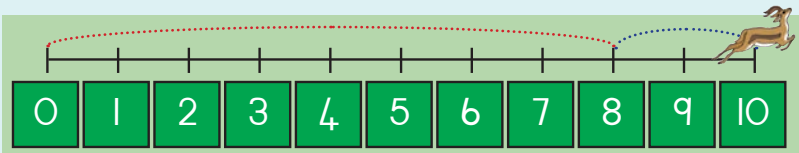

__ + __ = __



Sita logwaja kubhala sibalo.

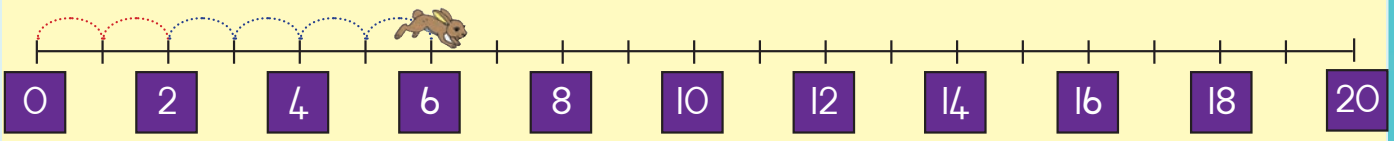

☐ + ☐ = ☐

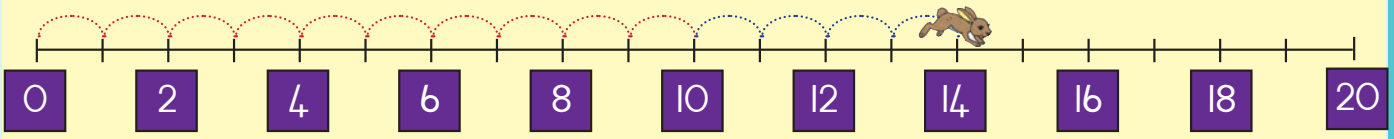

☐ + ☐ = ☐

Sita imphala kubhala sibalo.

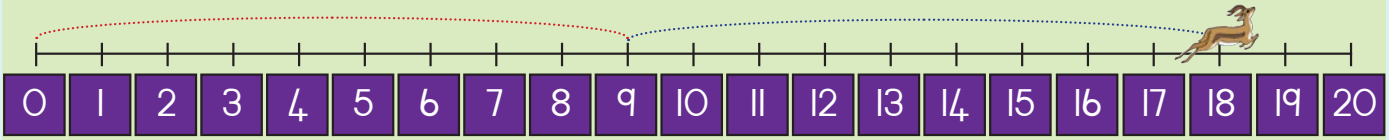

☐ + ☐ = ☐

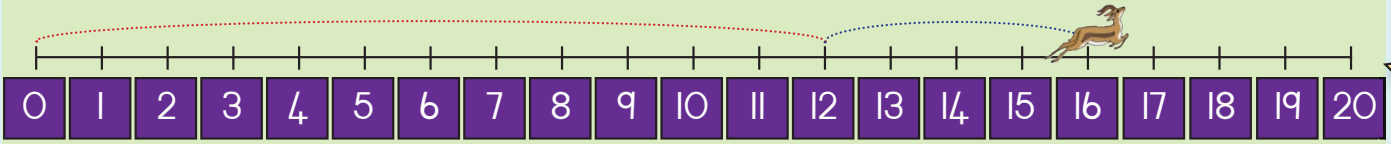

☐ + ☐ = ☐

Teacher:
Sign:
Date:

11 12 13 14 15 16 17 18 19 20

Lusuku:

Kuhlanganisa nekususa

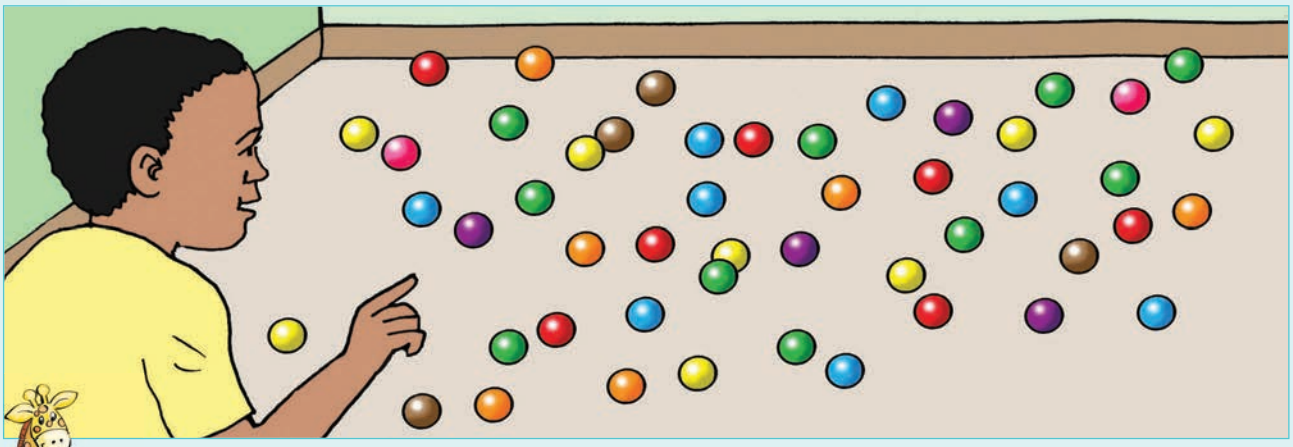

Bhala lelinani lebuhlalu.

Bungakhi buhlalu lobubovu lobulapho? ☐

Bungakhi buhlalu lobulingangane lobulapho? ☐

Bungakhi buhlalu lobuluhlata lobulapho? ☐

Bungakhi buhlalu lobuliphuti lobulapho? ☐

Bungakhi buhlalu lobusamsobo lobulapho? ☐

Bungakhi buhlalu sebubonkhe? ☐

Bhala linani lebuhlalu bembala ngamunye emabhokisini lafanele bese wenta sibalo sekubuhlanganisa

lobubovu	+	lobuluhlata	=	
lobumtfubi	+	lobuphinki	=	
lobuliphuti	+	lobulingangane	=	
lobusamsobo	+	lobuluhlata	=	
lobububendze	+	lobumtfubi	=	

Cedzela lamaphethini.





Hlanganisa buhlalu lobubovu nalobulingangane bese ufaka imphendvulo ebhokisini .

	+		=	15
8	+	7	=	
	+		+	=
8	+	2	+	5 =
	+		=	
9	+	6	=	
	+		+	=
9	+		+	=

Catsanisa lesitfombe nesibalo bese uniketa imphendvulo.

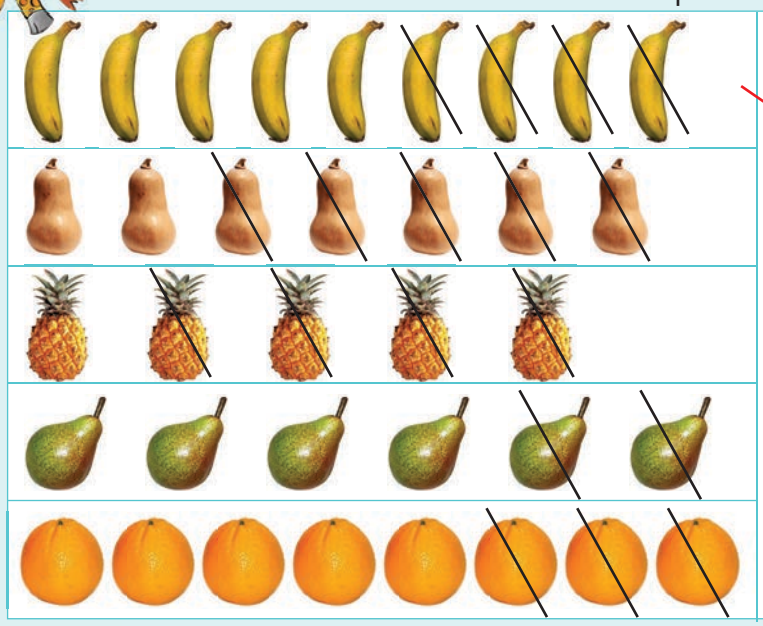

7 – 5 =	
9 – 4 =	
8 – 3 =	
5 – 4 =	
6 – 2 =	

Bhala sibalo saloku.

9 – 6 = 3	– =
– =	– =

Teacher:
Sign:
Date:

Lusuku:

Emalanga, emaviki netinyanga

uMsombuluko
Lesibili
Lesitsatfu
Lesine
Lesihlanu
uMgcibelo
Lisontfo

Bhimbidvwane	iNdlovana	iNdlovulenkhulu
Mabasa	iNkhwekhweti	iNhlaba
Kholwane	iNgci	iNyoni
iMphala	Lweti	iNgongoni

1 Phendvula lemibuto lelandzelako lengemalanga eliviki.

Nguliphi lilanga lelita ngaphambi kwaLesitsatfu? _____

Nguliphi lilanga lelita ngemuva kwaLesitsatfu? _____

Nguliphi lilanga lelita ngemuva kweMgcibelo? _____

Nguliphi lilanga lelita emkhatsini kweMsombuluko naLesitsatfu? _____

Uma uMsombuluko ulilanga lekucala, Lesihlanu yena lilanga lesi _____.

Nguwaphi emalanga leta emkhatsini kwaLesitsatfu neMgcibelo.

_____

2 Phendvula lemibuto lelandzelako ngetinyanga.

Nguyiphi inyanga lefika ngaphambi kwaMabasa? _____

Nguyiphi inyanga leta ngemuva kweNhlaba? _____

Nguyiphi inyanga leta emkhatsini kweNgci neMphala? _____

Ngutiphi tinyanga letita emkhatsini kwaBhimbidvwane neNhlaba?

_____

Nguyiphi inyanga yekucala yemnyaka? _____

Nguyiphi inyanga yekugcina yemnyaka? _____

Tinkholo eNingizimu Afrika	Imicimbi yemlandvo	Lusuku lwekutalwa
	Lilanga lemalungelo ebantfu Lilanga lenkhululeko Lilanga lebasebenti Lilanga lebantfu labasha Lilanga labomake lavelonkhe Lilanga lemagugu Lilanga lekucolelana	Lusuku Lwekutalwa lwami

Lokujutjiwe 2: Sebentisa Lokujutjiwe unamatsisele emaholide enkholo lamatsatfu nawo onkhe emaholide esive eNingizimu Afrika etinyangeni talekhalenda.

Bhimbidvwane	iNdlovana	iNdlovulenkhulu
Mabasa	iNkhwekhweti	iNhlaba
Kholwane	iNgci	iNyoni
iMphala	Lweti	iNgongoni

Teacher:
Sign:
Date:

Lusuku:

Kuhlanganisa



Bukisisa sitfombe ubhale linani letimabula umbala ngamunye emabhokisini lafanele bese wenta sibalo sekuhlanganisa konkhe.

labovu	+	lalingangane	=	3	+	4	=	
laluhlata	+	lalingangane	=		+		=	
laphinki	+	lalingangane	=		+		=	
laluhlata	+	laliphuti	=		+		=	
labovu	+	laluhlata	=		+		=	
laliphuti	+	lalingangane	=		+		=	

Hlanganisa.

3 + 2 =	4 + 6 =	9 + 3 =
6 + 5 =	7 + 8 =	8 + 4 =
9 + 5 =	8 + 6 =	7 + 4 =
9 + 9 =	7 + 5 =	8 + 8 =
7 + 6 =	9 + 6 =	7 + 7 =



3 Bhala sibalo saloku.

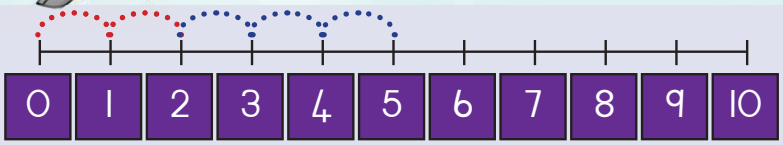

2 + 3 = 5

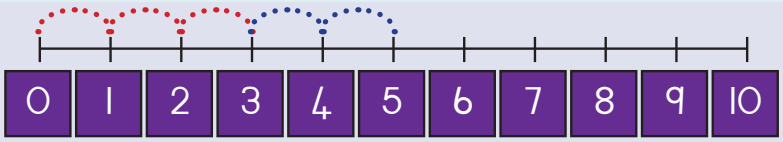

__ + __ = __

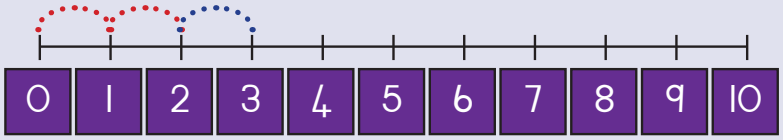

__ + __ = __

__ + __ = __

4 Hlanganisa buhlalu kwenta tikali tilingane. Kwekucala sesikwentele.

5 = 1 + 4

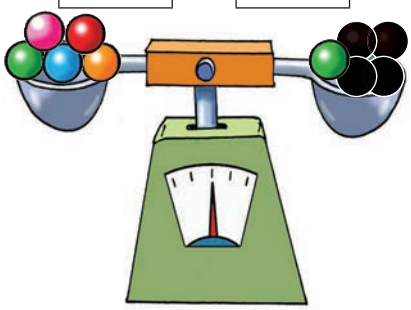

6 = 2 + __

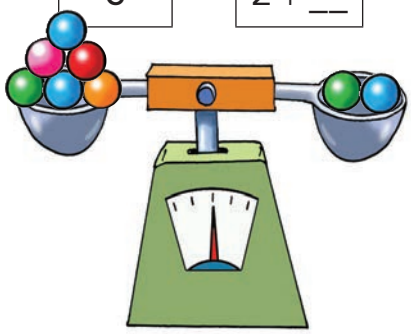

3 + __ = __



2 + 1 = 1 + __

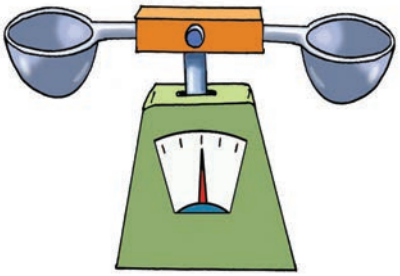

6 + 3 = 3 + __

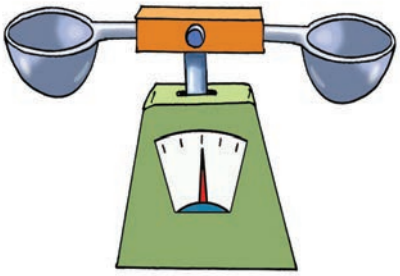

2 + __ = 8 + 2

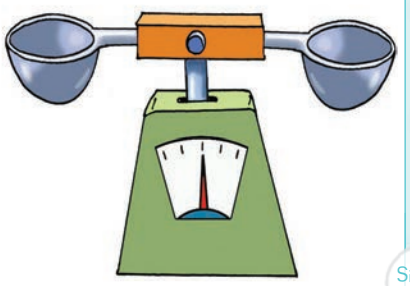

Teacher:
Sign:
Date:

11 12 13 14 15 16 17 18 19 20

Lusuku:

Kususa

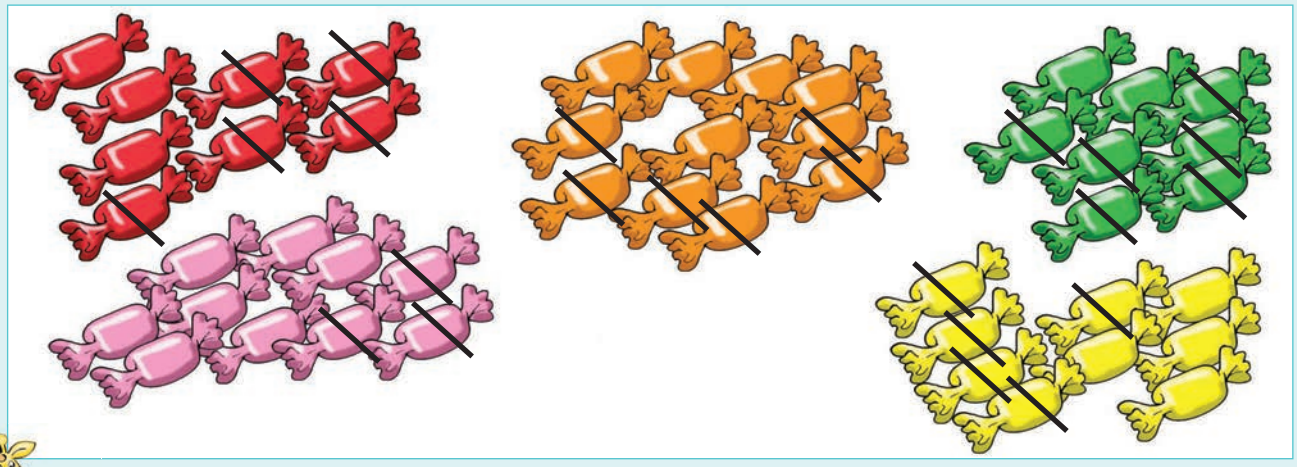

Buka kulesitfombe bese ubhala tibalo tekususa.

emaswidi labovu	=	8	–	5	=	3
emaswidi laluhlata	=		–		=	
emaswidi lamtfubi	=		–		=	
emaswidi laliphuti	=		–		=	
emaswidi laphinki	=		–		=	

Khipha.

5 – 3 =	10 – 6 =	12 – 3 =
11 – 5 =	15 – 7 =	12 – 4 =
14 – 9 =	14 – 8 =	11 – 4 =
18 – 9 =	12 – 5 =	16 – 8 =
13 – 7 =	15 – 6 =	14 – 7 =



Cedzela.

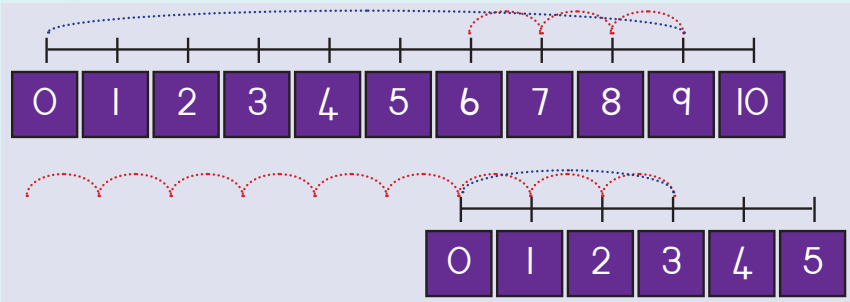

9 – 3

Akulingani na

3 – 9

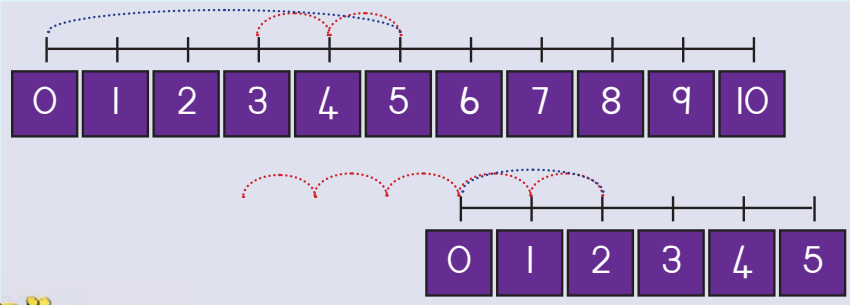

5 – 2

Akulingani na

2 – 5

Bhala sibalo sa.



☐ – ☐ = ☐

☐ – ☐ = ☐



☐ – ☐ = ☐

☐ – ☐ = ☐





☐ – ☐ = ☐

Teacher:

Sign:

Date:

11 12 13 14 15 16 17 18 19 20

Lusuku:

Kabanti ngekwengeta

1 Hlanganisa tinombolo ebhulokini ngalinye bese ubhala phasi linani lesamba.

2	8	7	5	3
10	10	10	10	10

2 Sebentisa lomugca-nombolo. Bhala sibalo sekuhlanganisa. Kwekucala sesikwentele.

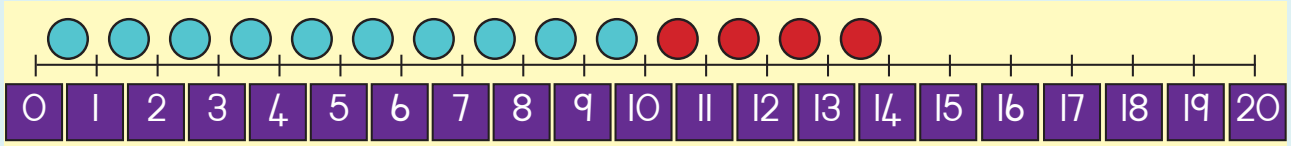

10 + 4 = 14

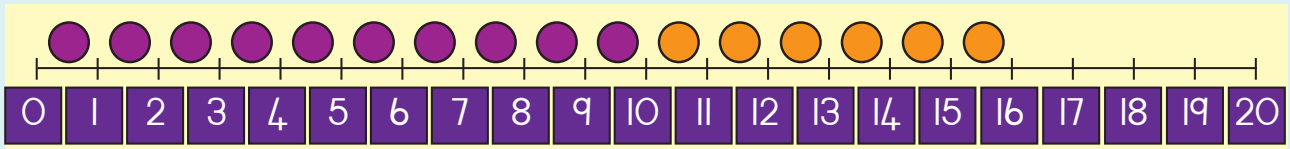

___ + ___ = ___

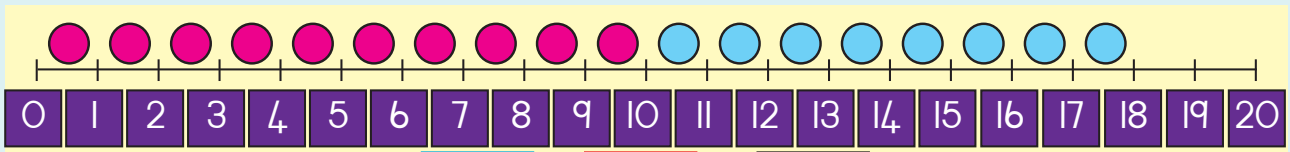

___ + ___ = ___

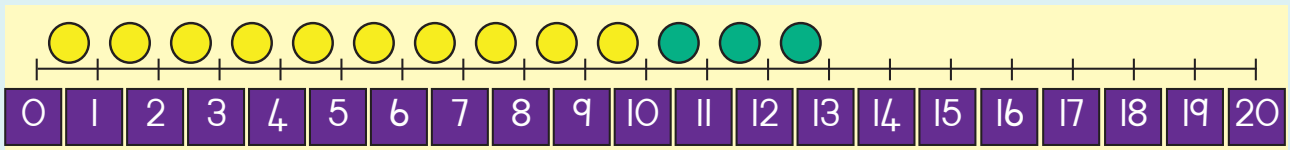

___ + ___ = ___



Hlanganisa.

10	+	3	=	13	10	+	2	=	
10	+	5	=		10	+	7	=	
10	+	1	=		10	+	6	=	
10	+	4	=		10	+	8	=	
10	+	9	=		10	+	3	=	

Hlanganisa.

16 + 13

10		10		20
6	+	3	=	9

16	+	13	=	29

14 + 12

10		10		
4	+	2	=	

	+		=	

17 + 11

10		10		
7	+	1	=	

	+		=	

15 + 13

10		10		
5	+	3	=	

	+		=	

16 + 12

10		10		
6	+	2	=	

	+		=	

18 + 12

10		10		
8	+	2	=	

	+		=	

Lisa unetintfo tekubala letingu 9 kantsi Aakar una 8.

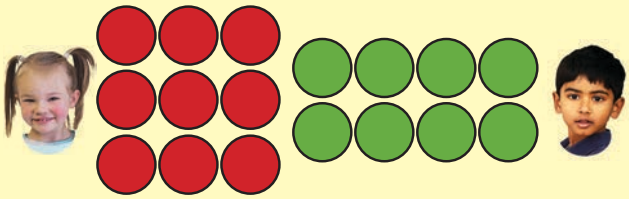

Itsini ithothali?

Teacher:

Sign:

Date:

11 12 13 14 15 16 17 18 19 20

Lusuku:

Imali

1 Kunani kulelidlelantfongeni lami?



2 Sika imali lebuhhehlu kuLokujutjiwe 3 bese unamatsisela emanani emali lafanele lapha.



3 Mangakhi emasenti?













4 Tibalo-magama.

Sisana una 50c. Unina umnika 20c ngetulu. Ngumalini Sisana lase anaye sekukonkhe?

_____

Ngina 90c. Ngitsenge liswidi la 30c. Senginamalini nyalo lesele?

_____

Teacher:
Sign:
Date:

11 12 13 14 15 16 17 18 19 20

Lusuku:

Imali yeliphepha

1 Inganani imali lesesipatjini sami?



2 Sika emaphepha-mali kuLokujutjiwe 3 bese unamatsisela emanani lafanele lapha.



3 Mangakhi emaRandi sekawonkhe?

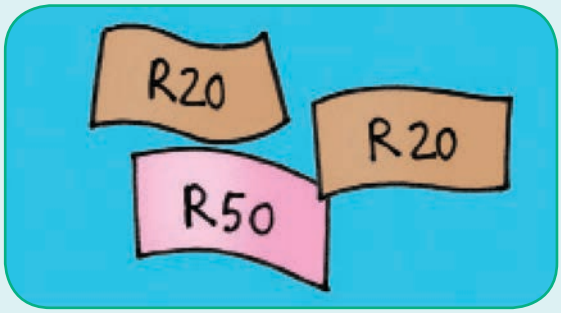

4 Tibalo-magama.

Ngonge R50. Ngatfola R20 welusuku lwami lwekutalwa. Senginamalini nyalo?

_____

Ngina R90. Ngitsenge incwadzi nga R30. Sengisele namalini?

_____

Teacher:
Sign:
Date:

11 12 13 14 15 16 17 18 19 20

Lusuku:

Emaphethini

1 Shaya tandla ulandzele lephethini.

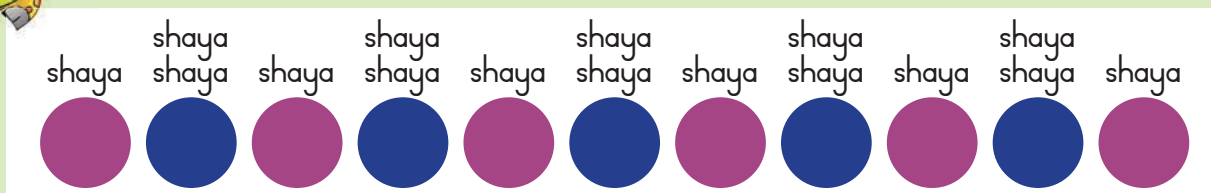



2 Kopa iphethini. Sebentisa Lokujutjiwe 4.



3 Yenta sitfombe sakho ngebuhlalu lobusele. Sebentisa Lokujutjiwe 4.

Kopa lamaphethini lalandzelako.

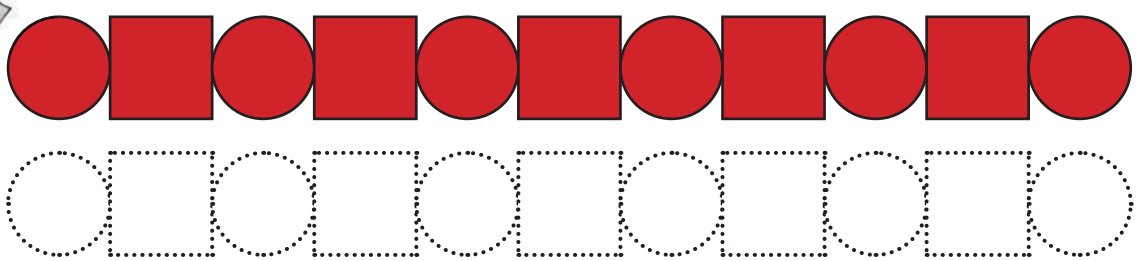

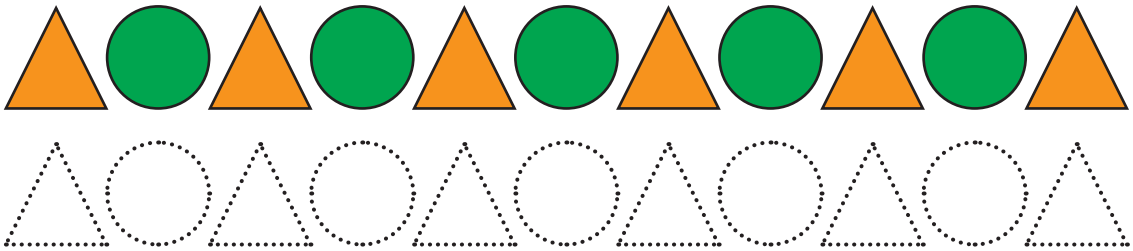

Kopa emaphethini.





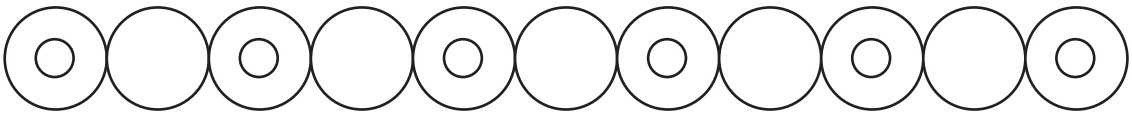

Teacher:
Sign:
Date:

Lusuku:

Lokwengetiwe ngemaphethini

1 Chaza iphethini ngayinye ngemagama. Lamagama langaphasi angakusita.



calandze | sikwele | calantsatfu | indilinga | imibala

2 Khetsa bese ufaka umbala kuleyo phethini letawulandzela.



3 Dvweba iphethini lelandzelako.



4 Khulisa lephethini.

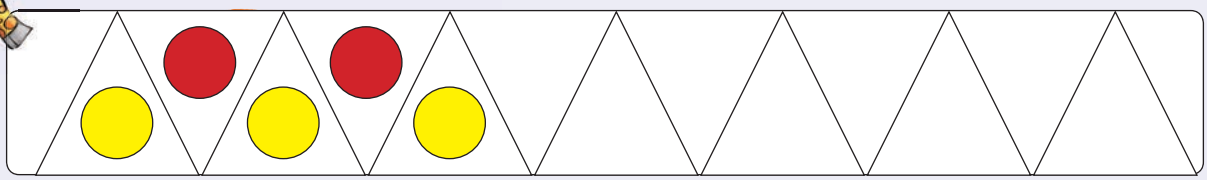

5 Dvweba emaphethini akho ngekusebentisa

6 Dvweba iphethini lelandzelako.

7 Cedzela loku lokulandzelako kute ube nendilinga yinye etulu.

8 Yakha emaphethini emibala akho ngekusebentisa labobunjwa labangaphasi.

Teacher:
Sign:
Date:

11 12 13 14 15 16 17 18 19 20

Lusuku:

Kuphindzaphindza: × 2

1 Mangakhi emaswidi lakhona etafuleni ngalinye?

Uwabale kanjani lamaswidi? (labanye bantfwana bangatsi 1, 2, 3... labanye batsi 2, 4, 6 ...)

2 Cedzela loku lokulandzelako. Kwekucala sesikwentele.

4 emacembu a 2	2 + 2 + 2 + 2 = 8	4 × 2 = 8
5 emacembu a 2	2 + 2 + 2 + 2 + 2 =	5 × 2 =
6 emacembu a 2	2 + 2 + 2 + 2 + 2 + 2 =	6 × 2 =
7 emacembu a 2	2 + 2 + 2 + 2 + 2 + 2 + 2 =	7 × 2 =
8 emacembu a 2	2 + 2 + 2 + 2 + 2 + 2 + 2 + 2 =	8 × 2 =

3 Yenta umdvwebo waloku lokulandzelako.

3 emacembu a 2	4 emacembu a 2	9 emacembu a 2

Yenta umdvwebo waloku lokulandzelako ugcwalise timphendvulo ngentasi.

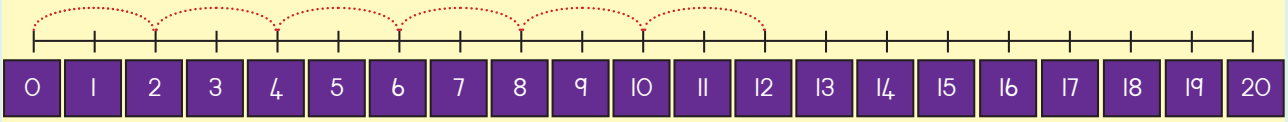

2, 4, 6, 8, ___ , ___

2 + 2 + 2 + 2 + 2 + 2 = ☐

6 emacembu a 2 = ☐

6 × 2 = ☐

Umdvwebo

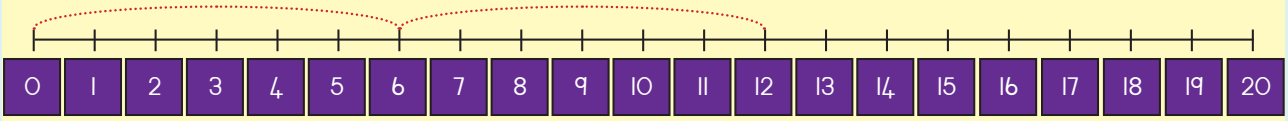

6, ___

6 + ☐ = ☐

2 emacembu a ☐ = ☐

2 × ☐ = ☐

Umdvwebo

Sayobi sinye sinemehlo lasi-8. Ngabe tayobi letisi-7 tinamangakhi emehlo?

☐

2 4 6 8 10 12 14

16 18 20 22 24 26

Teacher:
Sign:
Date:

11 12 13 14 15 16 17 18 19 20

Lusuku:

Kuphindzaphindza: × 5

1 Mangakhi emaswidi lakhona etafuleni ngalinye?



2 Cedzela loku lokulandzelako. Kwekucala sesikwentele.

3 emacembu a 5	5 + 5 + 5 = 15	3 × 5 = 15
2 emacembu a 5	5 + 5 =	2 × 5 =
4 emacembu a 5	5 + 5 + 5 + 5 =	4 × 5 =
6 emacembu a 5	5 + 5 + 5 + 5 + 5 + 5 =	6 × 5 =
7 emacembu a 5	5 + 5 + 5 + 5 + 5 + 5 + 5 =	7 × 5 =

3 Yenta umdvwebo waloku lokulandzelako.

3 emacembu a 5	4 emacembu a 5	5 emacembu a 5



Yenta umdvwebo waloku lokulandzelako ugcwalise timphendvulo ngentasi.

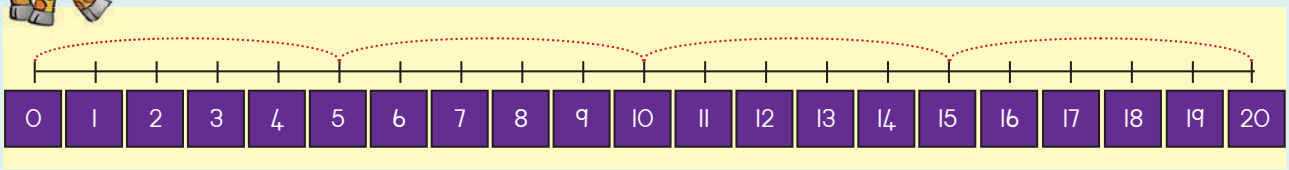

5, 10, 15, ___

5 + 5 + 5 + 5 = ☐

4 emacembu a 5 = ☐

4 × 5 = ☐

Umdvwebo

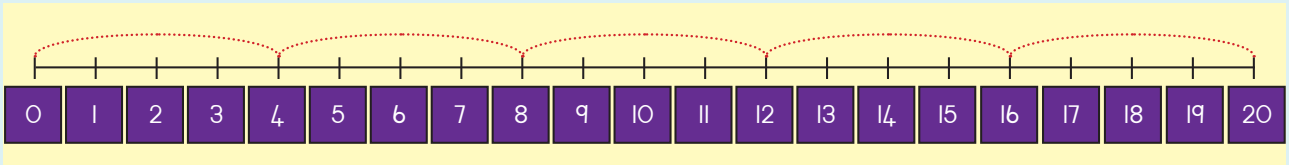

4, 8, 12, ___, ___

4 + 4 + 4 + 4 + 4 = ☐

5 emacembu a 4 = ☐

5 × 4 = ☐

Umdvwebo

5 10 15 20 25 30

35 40 45 50

Teacher:
Sign:
Date:

11 12 13 14 15 16 17 18 19 20

Lusuku:

Tindzaba ngekuphindzaphindza

1 Yenta indzaba yakho ngekusebentisa sibalo lesiphelele setindlebe, emehlo, tandla kanye netinyawo.

2 Sibangani labali-10. Sinetandla letingakhi?

Yenta umdvwebo.

Wukhombise ngetintfo tekubala.

Wukhombise kumugca-nombolo.

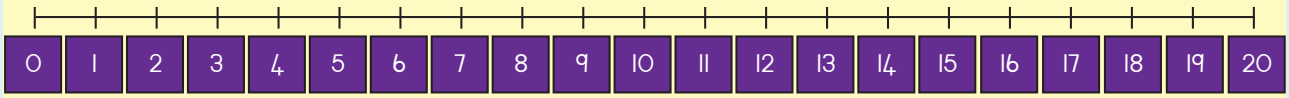

____ + ____ = ____ ____ × ____ = ____



3 Umndeni waSusan unemapheya lali-10 eticatfulo. Baneticatfulo letingakhi?

Yenta umdvwebo.

Wukhombise ngetintfo tekubala.

Wukhombise kumugca-nombolo.

0	1	2	3	4	5	6	7	8	9	10	11	12	13	14	15	16	17	18	19	20

____ + ____ = ____   ____ × ____ = ____

4 Bhala yakho indzaba usebentise bantfwana labasi-6 netandla tabo.

5 10 15 20 25 30 35

Teacher:
Sign:
Date:

Lusuku:

Timo sakhiwo letibusontsatfu (3D)

1 Faka umbala lobovu kuwo onkhe lamabhola, lolingangane kulamabhokisi kanye naloluhlata kulemibhoshongo.

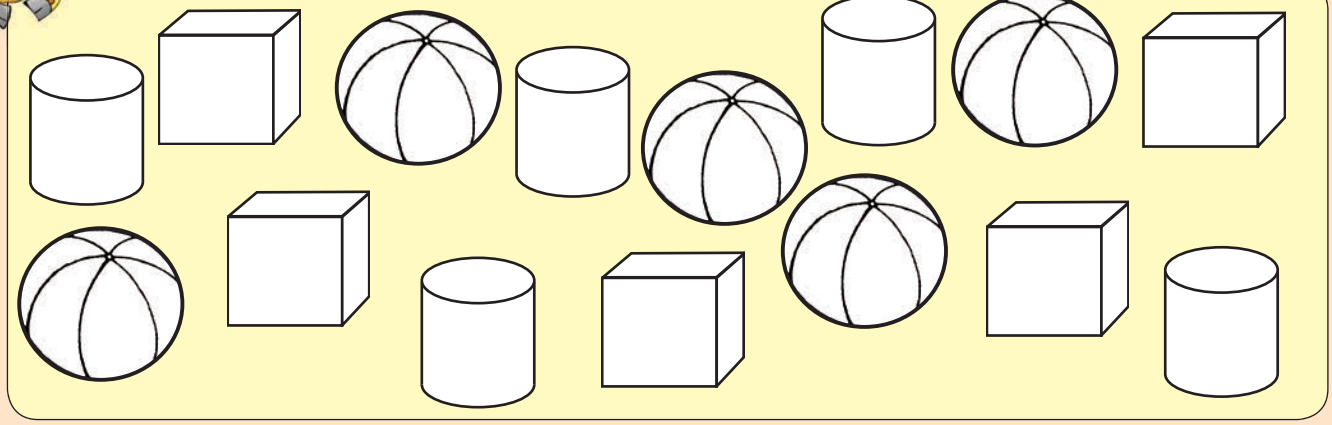

2 Khetsa ligama lelifanele.

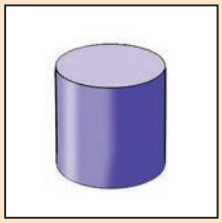

imiphetfo lecondzile

imiphetfo legwenjile

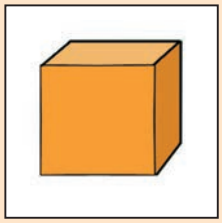

imiphetfo lecondzile

imiphetfo legwenjile

imiphetfo lecondzile

imiphetfo legwenjile



3 Shano kutsi lentfo itawugicika nobe itawushelela.

itawugicika

itawushelela

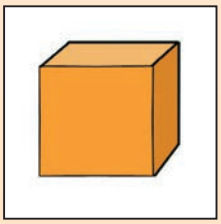

itawugicika

itawushelela

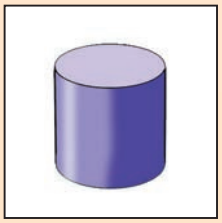

itawugicika

itawushelela

4 Kungakhi kwaletintfo lokubonako kulesitfombe: imibhoshongo, emabhokisi nemabhola?

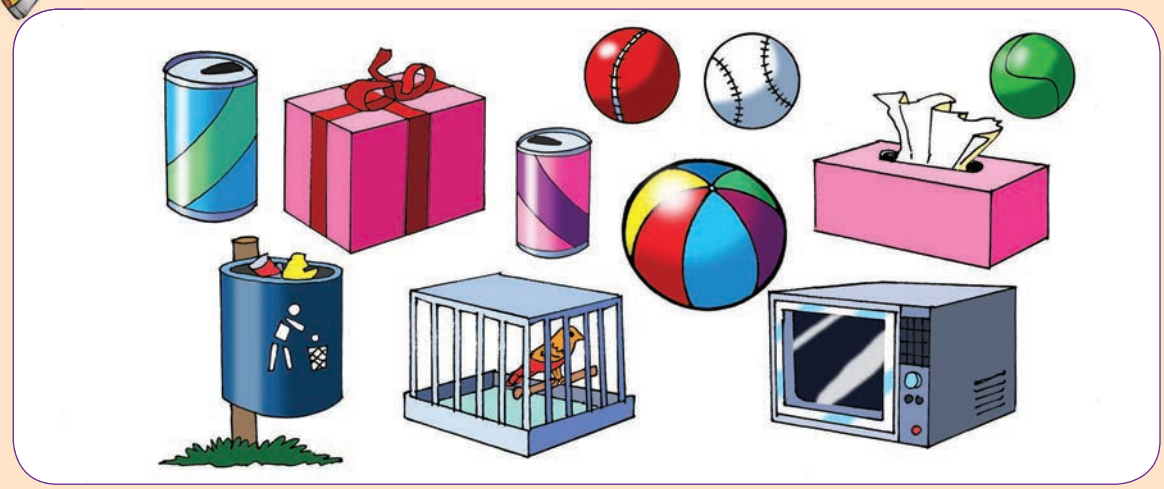

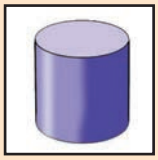

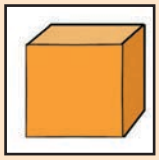

5 Ikuphi ibhola? Embi kwelibhokisi? Eceleni? Ngemuva? Ngetulu?

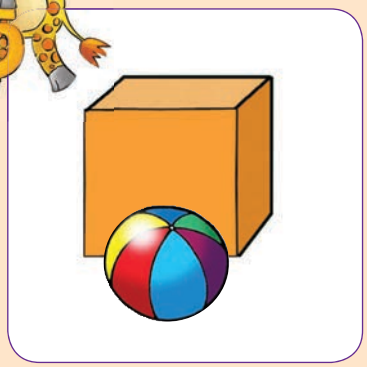

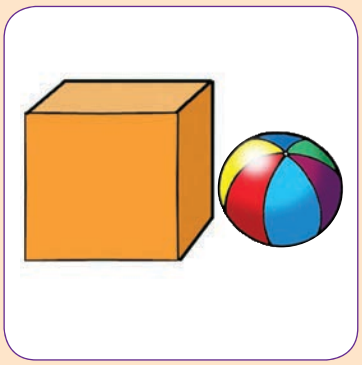

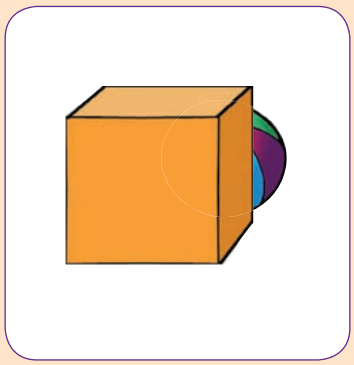

embi kwe___ eceleni ___

ngemva kwe ___ etu kwe ___

embi kwe___ eceleni ___

ngemva kwe ___ etu kwe ___

embi kwe___ eceleni ___

ngemva kwe ___ etu kwe ___

Teacher:

Sign:

Date:

11 12 13 14 15 16 17 18 19 20

Lusuku:

Hlela ucatsanise tinombolo: 1 – 40

1 Ngubani lonemawolintji lamanyenti?





Ngubani lonemahhabhula lamanyenti?



2 Gcwalisa emabhokisi langenalutfo.

1	2	3	4	5		7			10
	12				16		18		
21				25	26				30
31					36				40

3 Buka kulobuhlalu bese uphendvula lemibuto.

Nguyiphi inombolo lencane kuna 8? ☐

Nguyiphi inombolo lenkhulu kuna 13? ☐

Nguyiphi inombolo lencane kuna 20? ☐

Nguyiphi inombolo lencane kuna 24? ☐



Faka umbala lolingangane etinombolweni letincane kuna 10 kantsi kuletingetulu kwa 10 faka lobovu.

1	2	3	4	5	6	7	8	9	10
11	12	13	14	15	16	17	18	19	20

Faka umbala loluhlata etinombolweni letincane kuna 30 kantsi tingetulu kwa 24.

20	21	22	23	24	25	26	27	28	29	30

Faka umbala lomtfubi etinombolweni letincane kuna 40 kantsi tingetulu kwa 36.

30	31	32	33	34	35	36	37	38	39	40

Faka umbala lomtfubi etinombolweni leticondzile bese ufaka loluhlata etinombolweni lugweje.

1	2	3	4	5	6	7	8	9	10
11	12	13	14	15	16	17	18	19	20
21	22	23	24	25	26	27	28	29	30
31	32	33	34	35	36	37	38	39	40
41	42	43	44	45	46	47	48	49	50

Nguyiphi inombolo lugweje leta ngemuva kwa 10?	
Nguyiphi inombolo lecondzile leta ngaphambi kwa 10?	
Bhala phasi tinombolo leticondzile emkhatsini wa 14 na 24?	
Bhala phasi tinombolo lugweje emkhatsini wa 5 na 15?	
Nguyiphi inombolo lugweje leta nje ngemuva kwa 21?	
Nguyiphi inombolo lecondzile leta nje ngaphambi kwa 24?	
Bhala phasi tinombolo leticondzile emkhatsini wa 20 na 30?	
Bhala phasi tinombolo lugweje emkhatsini wa 20 na 30?	

Teacher:
Sign:
Date:

Lusuku:

Hlela ucatsanise: 40 – 50

1 Ngubani lonabophayinaphu labanyenti?





2 Bala buhlalu bese ugcwalisa emabhokisi langenalutfo.

1	2	3	4	5					
								19	
							28		

	32								
									30
51	52	53	54	55	56	57	58	59	60

3 Buka kulobuhlalu bese uphendvula lemibuto.

Nguyiphi inombolo lencane kuna 3? ☐

Nguyiphi inombolo lenkhulu kuna 31? ☐

Nguyiphi inombolo lencane kuna 38? ☐

Nguyiphi inombolo lencane kuna 47? ☐



Faka umbala loluhlata kuletinombolo letincane kuna 40 naletinkhulu kuna 36.

30	31	32	33	34	35	36	37	38	39	40

Tinombolo letincane kuna 40.

Tinombolo letinkhulu kuna 36.

Faka umbala lomtfubi etinombolweni leticondzile bese ufaka loluhlata etinombolweni

40	41	42	43	44	45	46	47	48	49	50

Ngumuphi nombolo lugweje lota ngemuva kwa 40?

Nguyiphi inombolo lecondzile leta ngaphambi kwa 43?

Bhala phasi tinombolo leticondzile emkhatsini wa 40 na 50?

Bhala phasi tinombolo lugweje emkhatsini wa 40 na 50?

Nguyiphi inombolo lecondzile leta ngemuva kwa 40?

Nguyiphi inombolo lecondzile leta ngaphambi kwa 41?

Teacher:
Sign:
Date:

Lusuku:

Tinombolo 40 – 50



Bungakhi buhlalu lobulapha?

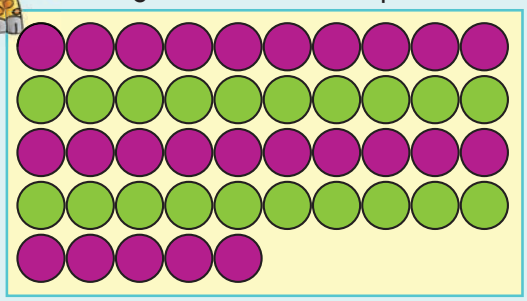

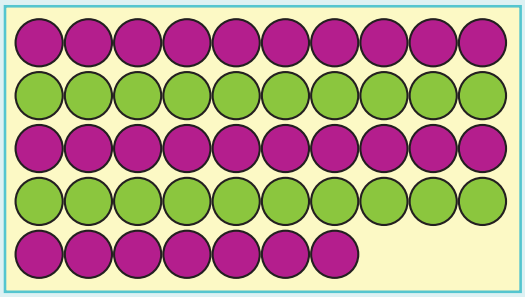

Inombolo	Singayibhala njenga:	Inombolo	Singayibhala njenga:
45	40 + 5 = 45		+ =

Cedzela loku lokulandzelako.

20	21	22							
30				34					
		42							

Cedzela loku lokulandzelako.



20 + 4 = 2 4

+ =



5 Bhala emagama aloku.

41	_____	42	_____
43	_____	44	_____
45	_____	46	_____
47	_____	48	_____
49	_____	50	_____

6 Buka sibonelo sekucala bese ucedzela konkhe lokulandzelako.

45	=	4	lishumi	+	5	emayunithi	44	=		lishumi	+		emayunithi
43	=		lishumi	+		emayunithi	41	=		lishumi	+		emayunithi
42	=		lishumi	+		emayunithi	48	=		lishumi	+		emayunithi

7 Bhala inombolo lengiyo esibayeni lesingiso.

	Emashumi	Emayunithi
27		
34		
46		
41		
39		

Teacher:
Sign:
Date:

11 12 13 14 15 16 17 18 19 20

Lusuku:

Tikwele, bocalandze, bocalantsatfu netindilinga

1 Gogo wente lomtfungo lomuhle. Khombisa bonkhe bobunjwa.

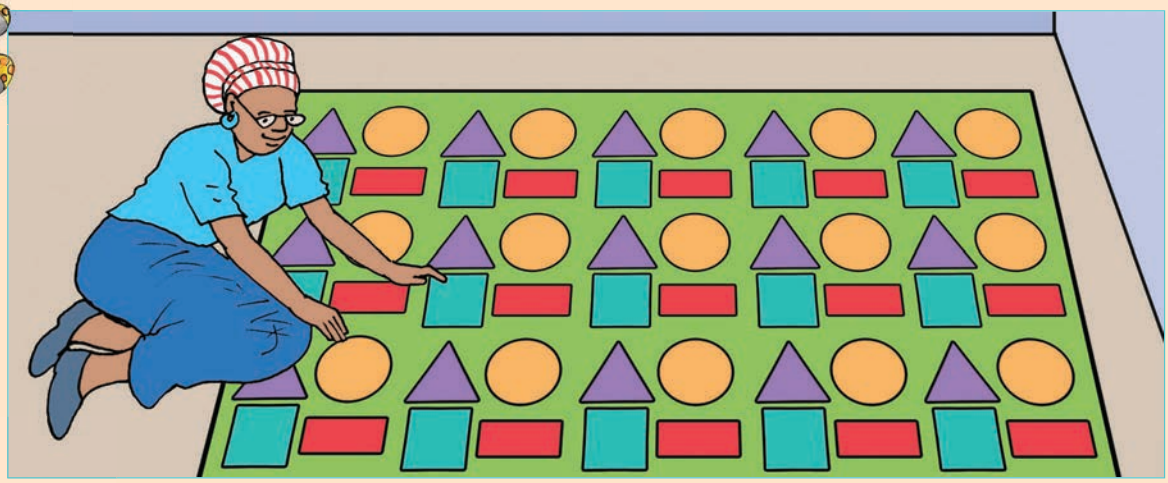

2 Faka umbala lolingangane kuletikwele, lomtfubi kulabocalandze, loluhlata kulabocalantsatfu kantsi lobovu kuletindilinga.

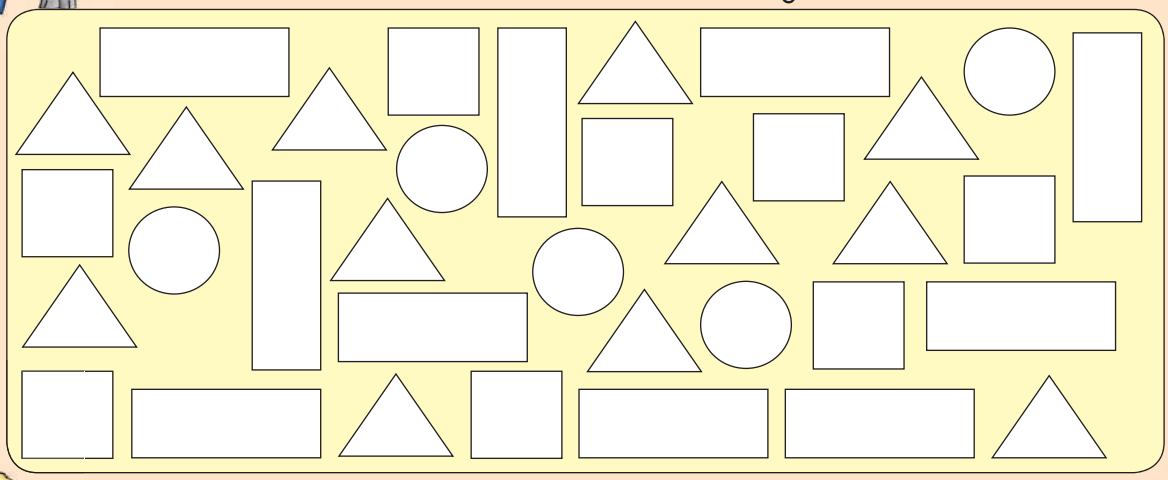

3 Khetsa bese ufaka umbala emphendvulweni lengiyo.

imiphetfo lecondzile

imiphetfo leyindilinga

imiphetfo lecondzile

imiphetfo leyindilinga



imiphetfo lecondzile

imiphetfo leyindilinga



imiphetfo lecondzile

imiphetfo leyindilinga



4 Bangakhi labobunjwa ● ■ ▲ ▬ lobatfolile?



● ▢ ■ ▢ ▲ ▢ ▬ ▢

5 Dvweba sitfombe sakho usebentise tindilinga, tikwele, bocalantsatfu nabocalandze.

Teacher:
Sign:
Date:

11 12 13 14 15 16 17 18 19 20

Lusuku:

Kuhlanganisa nekususa kufika ku 20

1

Kukhumbula masinyane.

4 + 5 − 1 =		13 − 9 + 2 =		20 − 7 + 1 =		10 + 5 − 4 =	
10 + 3 + 2 =		9 + 3 − 2 =		8 − 2 − 1 =		13 − 8 + 1 =	
9 − 4 − 3 =		18 − 9 − 4 =		7 + 8 + 1 =		16 − 7 + 3 =	
14 − 6 + 4 =		12 − 5 − 2 =		19 − 10 + 5 =		6 + 5 − 3 =	

2

Hlanganisa loku lokulandzelako.

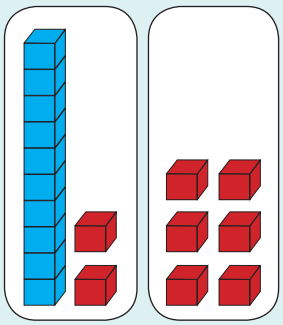

= 10 2 + 6

= 10 + 8

= 18

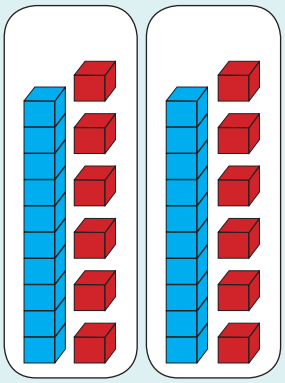

= +

= +

= +

=

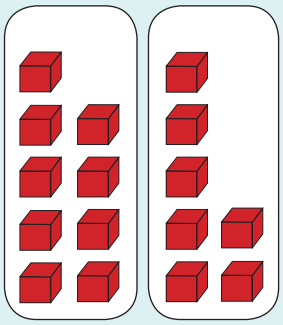

= +

= +

=

3 Susa loku lokulandzelako.

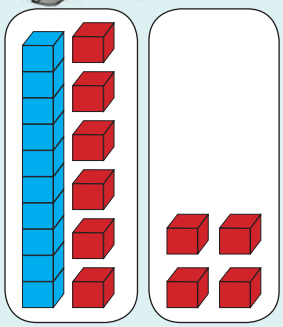

= 10 6 − 4

= 10 − 2

= 8

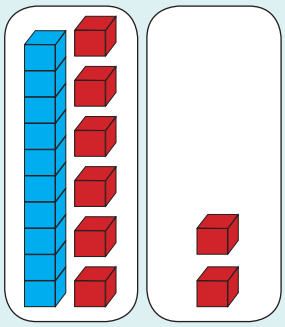

= ☐ ☐ − ☐ ☐

= ☐ + ☐

= ☐

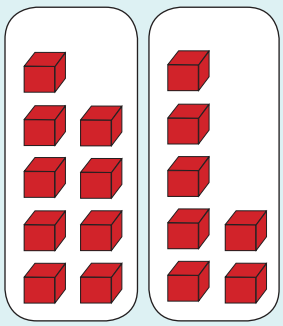

= ☐ − ☐

= ☐

4 Ngitsenge emaswidi langu 15. Ngidle 2.
Nginikete umngani wami 4. Nginemaswidi lamangakhi?



Teacher:
Sign:
Date:

11 12 13 14 15 16 17 18 19 20

Lusuku:

Kuhlanganisa nekususa kufika ku 50

1 Kukhumbula masinyane.

20 + 2 − 1 =		36 − 6 + 2 =		42 − 2 + 4 =		47 + 4 − 1 =	
30 + 3 + 6 =		42 + 9 − 1 =		33 − 2 − 1 =		49 − 1 + 2 =	
55 − 5 − 0 =		38 − 7 − 1 =		45 + 1 + 2 =		50 − 5 + 3 =	
24 − 3 + 2 =		32 − 5 − 2 =		49 − 10 + 1 =		29 + 5 − 4 =	

2 Hlanganisa loku lokulandzelako.

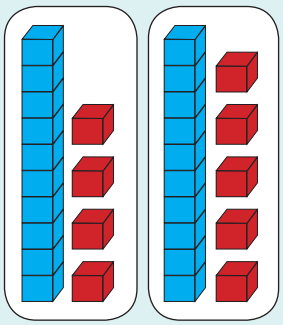

= ☐ ☐ + ☐ ☐

= ☐ + ☐

= ☐

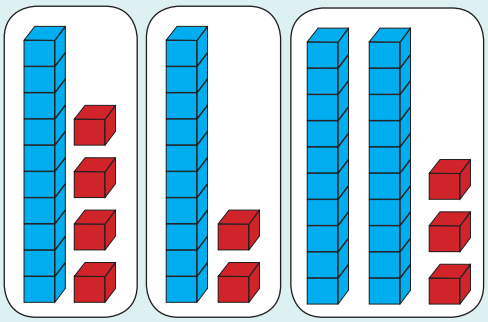

= ☐ ☐ + ☐ ☐ + ☐ ☐

= ☐ + ☐

= ☐

Sale usebentisa indlela yakho.



3 Susa loku lokulandzelako.

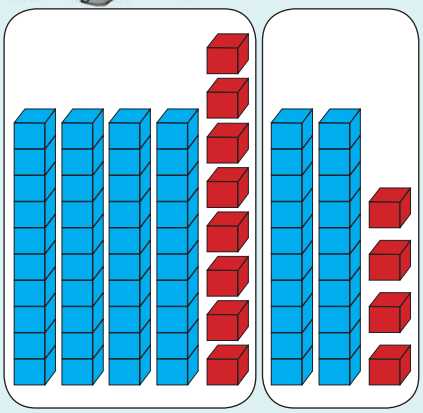

= 40 8 − 20 4

= 40 − 20 + 8 − 4

= 20 + 4

= 24

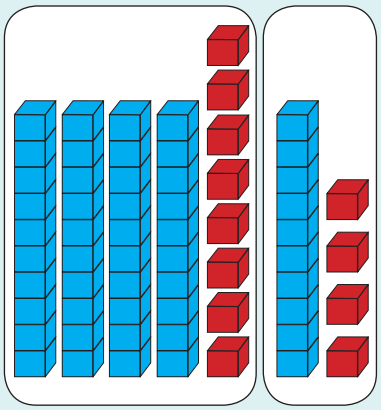

= ☐ ☐ − ☐ ☐

= ☐ − ☐ + ☐ − ☐

= ☐ + ☐

= ☐

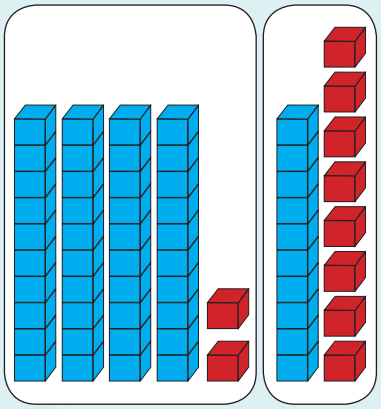

= ☐ ☐ − ☐ ☐

= ☐ − ☐ + ☐ − ☐

= ☐ − ☐

= ☐

4 Ngina R10, R5, R20 na R2 kulidlelantfongeni lami. Ngonge malini?

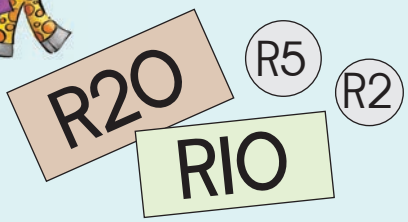

Teacher:
Sign:
Date:

11 12 13 14 15 16 17 18 19 20

Lusuku:

Kuhlanganisa lokwengetiwe

1 Hlanganisa tinombolo ebhulokini ngalinye bese ubhala linani lesamba.

1 10 5 10	2 10 6 20	3 20 5 20	4 20 4 10

2 Hlanganisa:

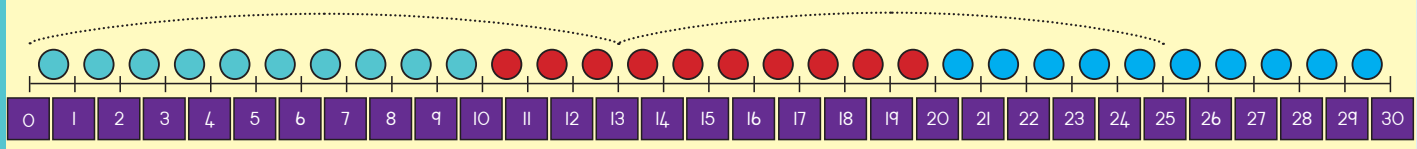

13 + 12 = ____

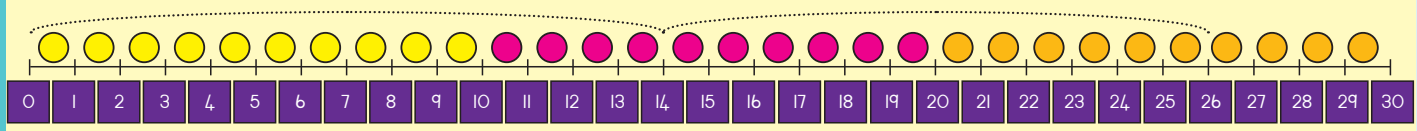

14 + 12 = ____

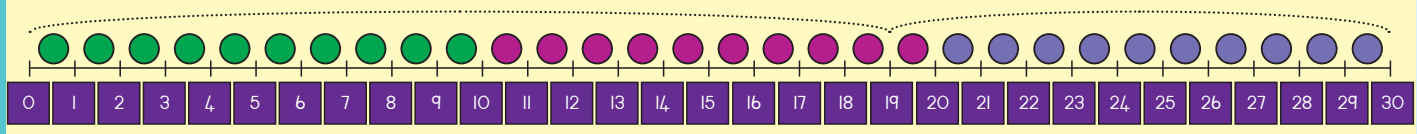

19 + 11 = ____

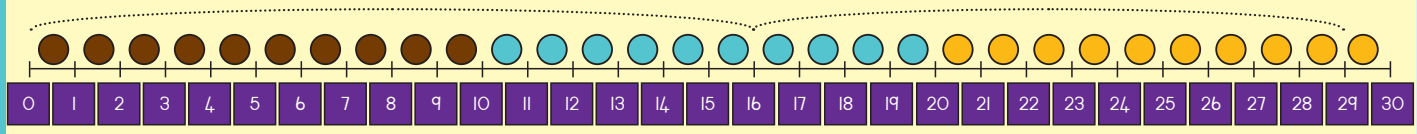

16 + 13 = ____

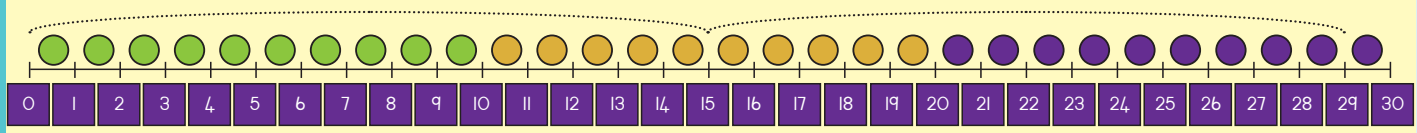

15 + 14 = ____

3 Hlanganisa:

12 + 11

= 10 2 + 10 1

= 10 + 10 + 2 + 1

= 20 + 3

= 23

13 + 15

= ☐ ☐ + ☐ ☐

= ☐ + ☐ + ☐ + ☐

= ☐ + ☐

= ☐

26 + 12

= ☐ ☐ + ☐ ☐

= ☐ + ☐ + ☐ + ☐

= ☐ + ☐

= ☐

23 + 22

= ☐ ☐ + ☐ ☐

= ☐ + ☐ + ☐ + ☐

= ☐ + ☐

= ☐

24 + 13

= ☐ ☐ + ☐ ☐

= ☐ + ☐

= ☐

35 + 12

= ☐ ☐ + ☐ ☐

= ☐ + ☐

= ☐

4 Betty utsenge emaswidi aR36, Sipho watsenga aR13. Batsenge ngamalini seyiyonkhe?

Teacher:

Sign:

Date:

11 12 13 14 15 16 17 18 19 20

Lusuku:

Kuhlanganisa lokwengetiwe (kuyachutjekiswa)

1 Bhala linani lesamba.

12 + 10 = ☐

15 + 10 = ☐

19 + 10 = ☐

2 Dvweba bonkhe lobuhlalu bese ucedzela letibalo.

0 10 20 30

☐ + ☐ + ☐ + ☐ = ☐

0 10 20 30

☐ + ☐ + ☐ + ☐ = ☐

0 10 20 30

☐ + ☐ + ☐ + ☐ = ☐

0 10 20 30

☐ + ☐ + ☐ + ☐ = ☐

1 2 3 4 5 6 7 8 9 10



3 Cedzela.

28	+	11	=	2	8	+	10	+	1	=	38	+	1	=	39
34	+	12	=	3	4	+	10	+	2	=		+		=	
23	+	13	=	2	3	+	10	+	3	=		+		=	
35	+	12	=	3	5	+	10	+	2	=		+		=	
26	+	11	=	2	6	+	10	+	1	=		+		=	

4 Hlanganisa

11 + 10 =		23 + 10 =		36+ 10 =	
28 + 10 =		37 + 10 =		12 + 10 =	
34 + 10 =		29 + 10 =		15 + 10 =	

5 Samba sa 27 na 16 ngu? ☐

Dvweba sitfombe kukhombisa imphendvulo yakho.

6 Yenta sibalo sakho semagama ngekusebentisa titfombe.



Teacher:
Sign:
Date:

11 12 13 14 15 16 17 18 19 20

Lusuku:

Budze



Faka umbala emphendvulweni lengiyo kukhombisa kutsi ngabe lamahele neluhlu kufishanyana noma kujana, kufishanyana noma kuphakeme, kubantana noma kuncanyana. Faka umbala emphendvulweni yakho ufane nalowo lokumabhuloki.

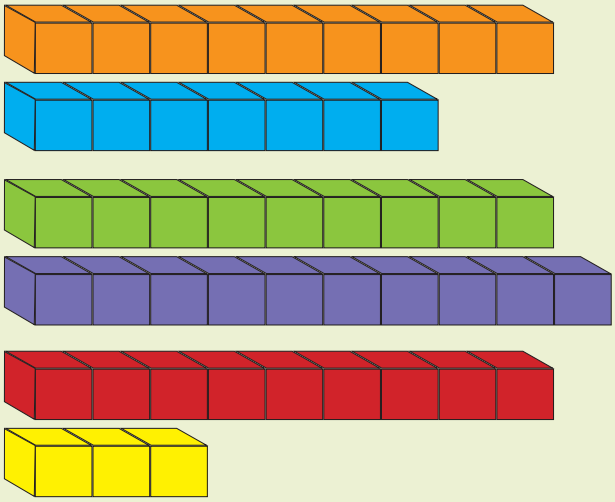

kufisha | kujana

kufisha | kujana

kufisha | kujana

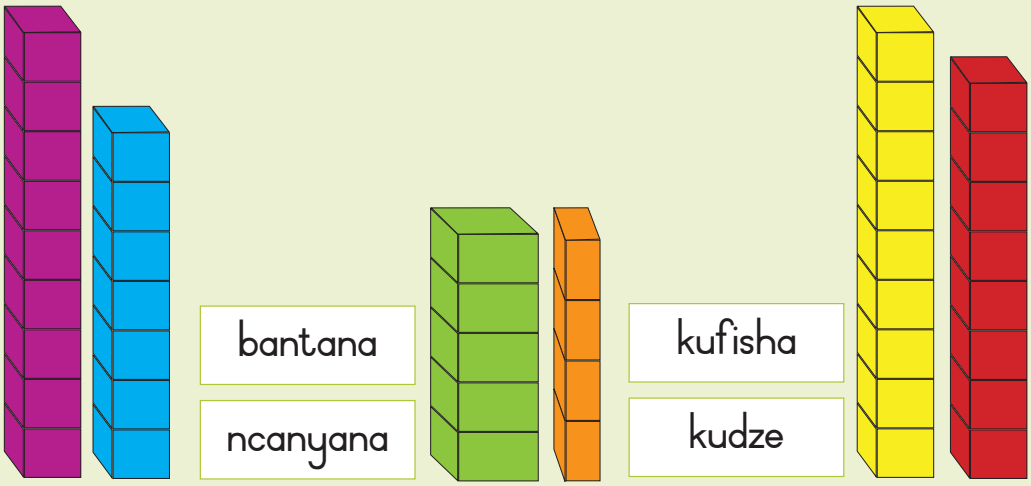

kufisha | kudze

bantana | ncanyana

kufisha | kudze

2 Khomba kutsi ngumuphi umfana lomudze. Faka umbala lofana nemabhulukwe emfana.

mfisha | mudze

mudze | mfisha

mfisha | mudze

3 Linganisa emacala elibala lekudlala ngesandla nangelunyawo kuLokujutjiwe I

Ngabe libala lekudlala lidze ngetandla letingakhi? _____

Ngabe libala lekudlala lidze ngetinyawo letingakhi? _____

budze



Teacher:
Sign:
Date:

11 12 13 14 15 16 17 18 19 20

Lusuku:

Kususa (kuyachutjekiswa)

1 Condzanisa emakhadi netibalo tekususa.

10	10	10	10	10
2 2	8 8	7 7	5 5	3 3
17 – 7 = 10	12 – 2 = 10	15 – 5 = 10	13 – 3 = 10	18 – 8 = 10

2 Sebentisa lomugca-nombolo. Bhala sibalo sekususa.

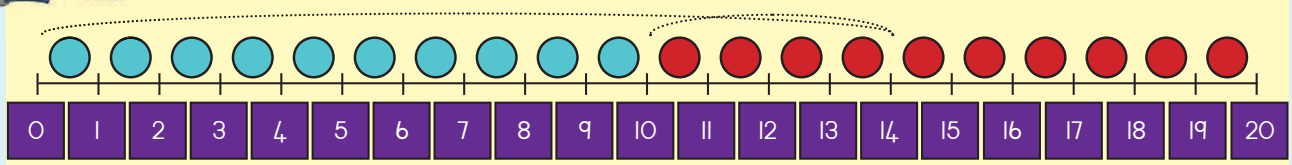

14 – 4 = 10

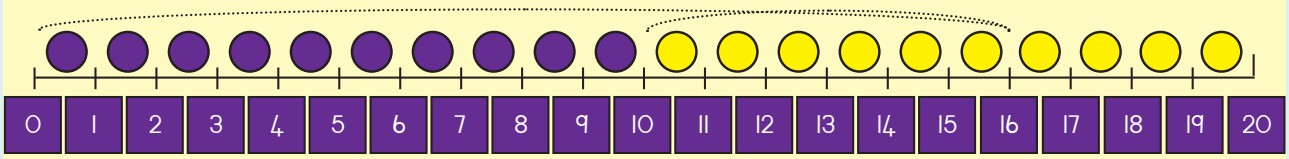

_____ – _____ = _____

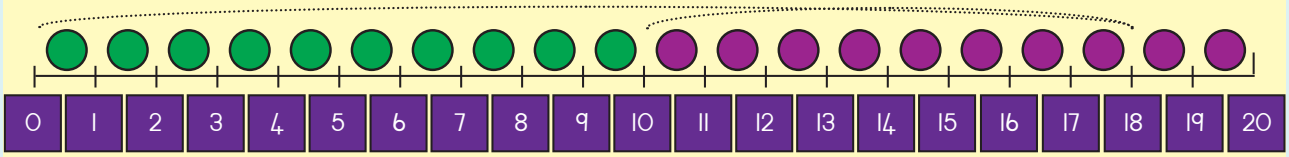

_____ – _____ = _____

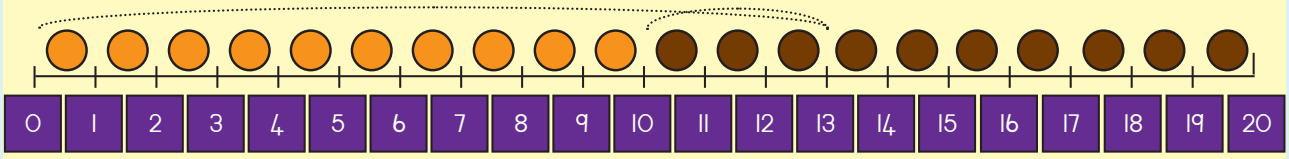

_____ – _____ = _____

Kususa.

10	3	–	3	=			
10	5	–	5	=			
10	1	–	1	=			
10	4	–	4	=			
10	9	–	9	=			

10	2	–	2	=			
10	7	–	7	=			
10	6	–	6	=			
10	8	–	8	=			
10	9	–	5	=			

Kususa.

16 – 13

10		10		20	
6	–	3	=	3	
16	–	13	=	3	

14 – 12

10		10			
4	–	2	=		
14	–	12	=		

27 – 11

20		10			
7	–	1	=		
	–		=		

35 – 13

30		10			
5	–	3	=		
	–		=		

26 – 12

20		10			
6	–	2	=		
	–		=		

48 – 11

40		10			
8	–	1	=		
	–		=		

Lisa unetintfo tekubala letingu 17. Ulahlekelwe tintfo tekubala letingu 8.



Usele netintfo tekubala letingakhi? ☐

Teacher:
Sign:
Date:

11 12 13 14 15 16 17 18 19 20

Lusuku:

Lokunye ngekususa

1

Khipha tinombolo letingaphasi kuleti letingetulu.

10 − 7 = 17	20 − 2 =	30 − 8 =	40 − 9 =
10 − 5 = 15	10 − 1 =	10 − 5 =	10 − 4 =
2			

2

Sebentisa lomugca-nombolo. Bhala sibalo sekususa.

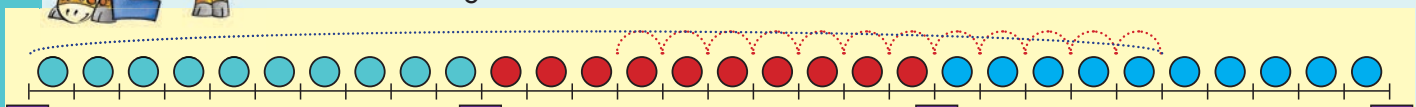

25 − 12 = ☐

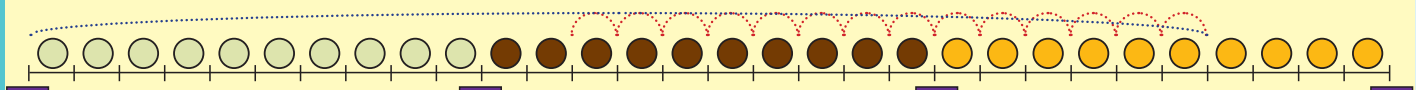

☐ − ☐ = ☐

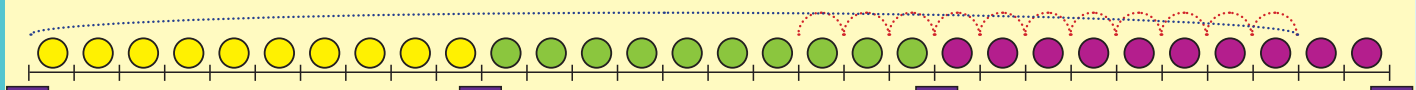

☐ − ☐ = ☐

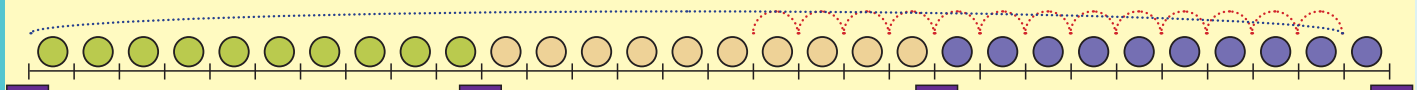

☐ − ☐ = ☐

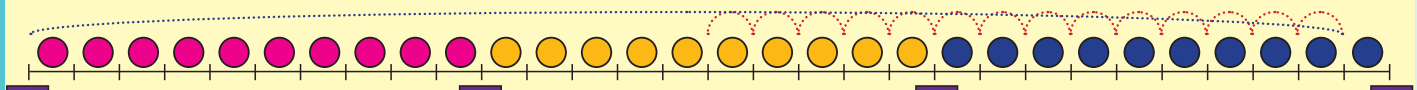

☐ − ☐ = ☐



Kususa.

45 – 23

= 40 5 – 20 3

= 40 – 20 + 5 – 3

= 20 + 2

= 22

38 – 16

= ☐ ☐ – ☐ ☐

= ☐ – ☐ + ☐ – ☐

= ☐ + ☐

= ☐

29 – 14

= ☐ ☐ – ☐ ☐

= ☐ – ☐ + ☐ – ☐

= ☐ + ☐

= ☐

48 – 11

= ☐ ☐ – ☐ ☐

= ☐ – ☐ + ☐ – ☐

= ☐ + ☐

= ☐

35 – 23

= ☐ ☐ – ☐ ☐

= ☐ – ☐ + ☐ – ☐

= ☐ + ☐

= ☐

38 – 15

= ☐ ☐ – ☐ ☐

= ☐ – ☐ + ☐ – ☐

= ☐ + ☐

= ☐

Teacher:

Sign:

Date:

11 12 13 14 15 16 17 18 19 20

Lusuku:

Lokwengetiwe ngekunciphisa

1 Susa bese ufaka imphendvulo ebhokisini lelingenalutfo.

22 – 10 = ☐

25 – 10 = ☐

29 – 10 = ☐

2 Cedzela tibalo tekususa.

0 10 20 30

☐ – ☐ – ☐ = ☐

0 10 20 30

☐ – ☐ – ☐ = ☐

0 10 20 30

☐ – ☐ – ☐ = ☐

0 10 20 30

☐ – ☐ – ☐ = ☐

1 2 3 4 5 6 7 8 9 10



Cedzela.

46	–	13	=	49	–	23	=
38	–	14	=	27	–	16	=
25	–	11	=	46	–	32	=

Susa.

21 – 10 =	43 – 10 =	16 – 10 =
28 – 10 =	27 – 10 =	22 – 10 =
34 – 10 =	37 – 10 =	45 – 10 =

Umehluko emkhatsini wa 35 na 20 ngu? Dvweba sitfombe kukhombisa imphendvulo yakho.

35 – 20 = _____

Yenta sibalo semagama sakho ngekusebentisa titfombe.



Teacher:
Sign:
Date:

11 12 13 14 15 16 17 18 19 20

Lusuku:

Kwesindza nebumalula

1 Buka sitfombe ngasinye bese uphendvula umbuto.

Ngukuphi lokumalula kakhulu? Ngukuphi lokwesindza kakhulu?





2 Namatsisela noma udvwebe titfombe taloku.

Tintfo letesindzako	Tintfo letimalula

1 2 3 4 5 6 7 8 9 10

Uma butjoki lobubovu bukhombe kulelicala lelimtfubi lentfo imalula kantsi uma bukhombe ecaleni lelilingangane intfo iyesindza. Bhala kumalula noma kuyesindza.



kumalula











Dvweba noma unamatsisele tintfo kuye ngaloko lokukhonjiswa ngulesikali.

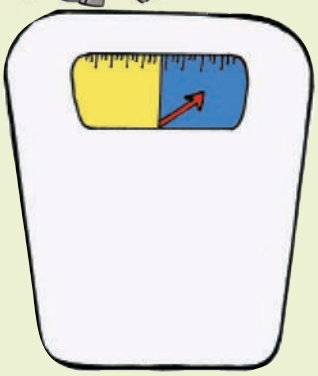

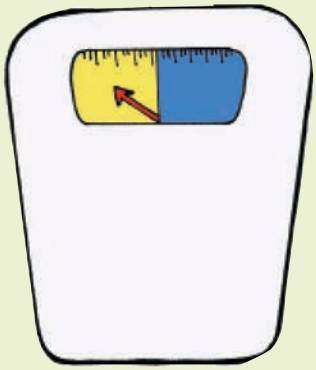

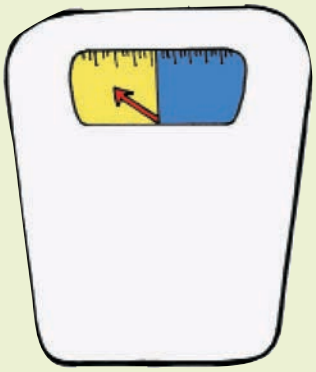

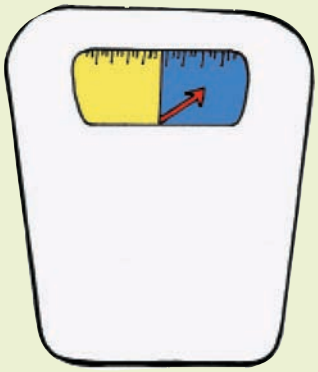

Teacher:
Sign:
Date:

11 12 13 14 15 16 17 18 19 20

Lusuku:

Emaphethini etinombolo: ngakubili

1 Asibaleni ngakubili.



2 Dvweba nobe namatsisela tintfo letita ngatimbili.

3 Siyicalile iphethini. Yicedzele.

1	2	3	4	5	6	7	8	9	10
11	12	13	14	15	16	17	18	19	20
21	22	23	24	25	26	27	28	29	30
31	32	33	34	35	36	37	38	39	40
41	42	43	44	45	46	47	48	49	50
51	52	53	54	55	56	57	58	59	60
61	62	63	64	65	66	67	68	69	70
71	72	73	74	75	76	77	78	79	80
81	82	83	84	85	86	87	88	89	90
91	92	93	94	95	96	97	98	99	100



Sebentisa lomugca-nombolo kubhala iphethini.

0 1 2 3 4 5 6 7 8 9 10

2 4 6 8 10

10 11 12 13 14 15 16 17 18 19 20

20 21 22 23 24 25 26 27 28 29 30

0 1 2 3 4 5 6 7 8 9 10

Cedzela loku lokulandzelako.

2, 4, 6, __, __, __	13, 15, 17, __, __, __	26, 24, 22, __, __, __
62, 64, 66, __, __, __	55, 57, 59, __, __, __	11, 9, 7, __, __, __
44, 46, 48, __, __, __	10, 8, 6, __, __, __	29, 27, 25, __, __, __
1, 3, 5, __, __, __	98, 96, 94, __, __, __	95, 93, 91, __, __, __

2 4 6 8 10 12 14 16 18 20

Teacher:
Sign:
Date:

11 12 13 14 15 16 17 18 19 20

Lusuku:

Kuphindza kabili

1 Bukisisa sitfombe sekucala nesesibili. Kwentekeni?



2 Hlanganisa emacashata, bese ubhala sibalo salokuhlangene.

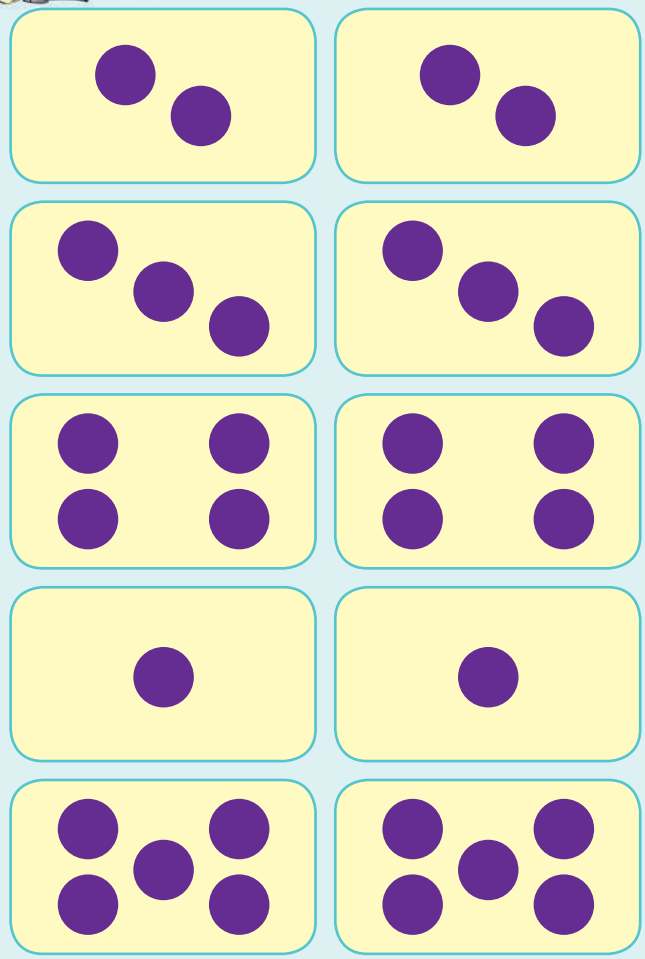

☐ + ☐ = ☐

☐ + ☐ = ☐

☐ + ☐ = ☐

☐ + ☐ = ☐

☐ + ☐ = ☐



Sebentisa imigca-nombolo kubhala sibalo.

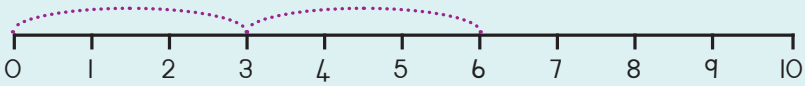

☐ + ☐ = ☐

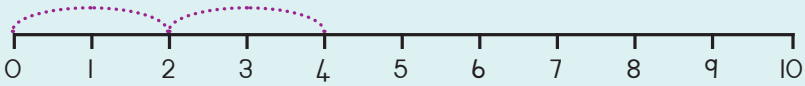

☐ + ☐ = ☐

☐ + ☐ = ☐

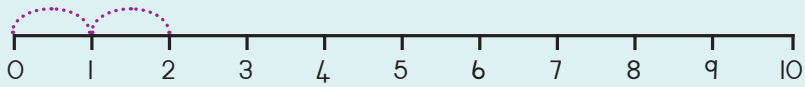

☐ + ☐ = ☐

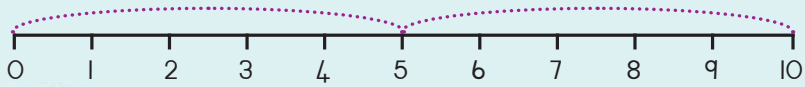

☐ + ☐ = ☐

Phindza loku lokulandzelako.

Phindza kabili 1	1	+	1	=	2	2	×	1	=	2
Phindza kabili 2	☐	+	☐	=	☐	2	×	☐	=	☐
Phindza kabili 3	☐	+	☐	=	☐	2	×	☐	=	☐
Phindza kabili 4	☐	+	☐	=	☐	2	×	☐	=	☐
Phindza kabili 5	☐	+	☐	=	☐	2	×	☐	=	☐

Ngina R5. Umngani wami unalokuphindvwe kabili kulokwami. Umngani wami unamalini?

Teacher:
Sign:
Date:

11 12 13 14 15 16 17 18 19 20

Lusuku:

Phindza kabili futsi

1 Bukisisa sitfombe sekucala nesesibili. Kwentekeni?



2 Hlanganisa emacashata, bese ubhala sibalo ngasinye.



☐ + ☐ = ☐

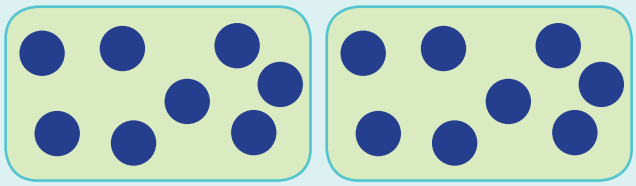

☐ + ☐ = ☐

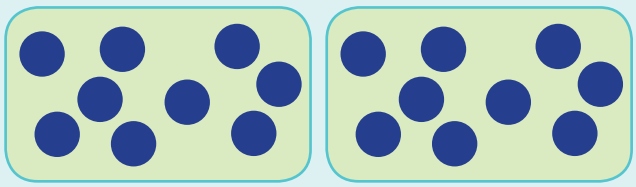

☐ + ☐ = ☐

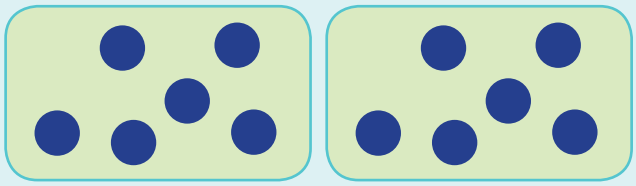

☐ + ☐ = ☐

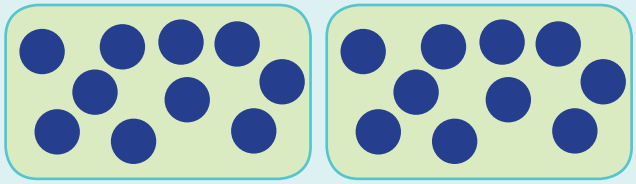

☐ + ☐ = ☐



3 Sebentisa imigca-nombolo kubhala sibalo.

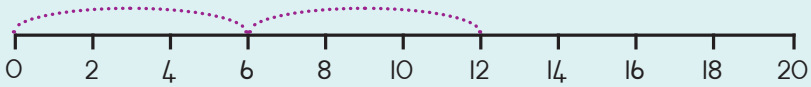

☐ + ☐ = ☐

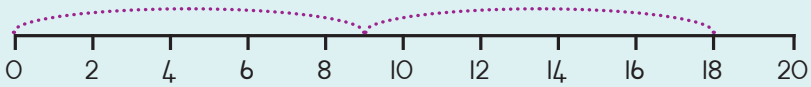

☐ + ☐ = ☐

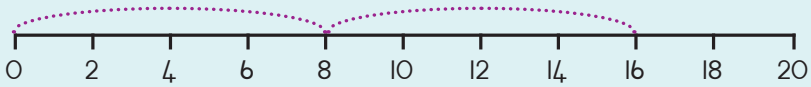

☐ + ☐ = ☐

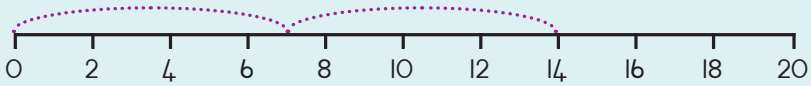

☐ + ☐ = ☐

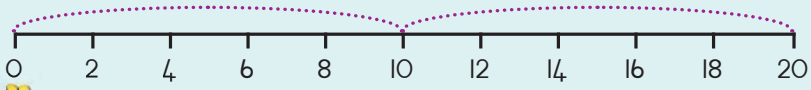

☐ + ☐ = ☐

4 Phindza loku lokulandzelako.

Phindza kabili 6	☐ + ☐ = ☐	2 × 6 = 12
Phindza kabili 7	☐ + ☐ = ☐	2 × ☐ = ☐
Phindza kabili 8	☐ + ☐ = ☐	2 × ☐ = ☐
Phindza kabili 9	☐ + ☐ = ☐	2 × ☐ = ☐
Phindza kabili 10	☐ + ☐ = ☐	2 × ☐ = ☐

5 Umngani wami unemamabuli langu 9. Ami aphindvwe kabili kulawakhe. Mangakhi emamabuli ami?

Teacher:
Sign:
Date:

Lusuku:

Phindza kabili

Phindza kabili 8

1 2 3 4 5 6 7 8 1 2 3 4 5 6 7 8

1 2 3 4 5 6 7 8 9 10 11 12 13 14 15 16

Phindza kabili 9

1 2 3 4 5 6 7 8 9 1 2 3 4 5 6 7 8 9

1 2 3 4 5 6 7 8 9 10 11 12 13 14 15 16 17 18

Biyela lobuhlalu kute uphindze kabili tinombolo. Sikucalele loku kwekucala.

Phindza kabili 5

5 + 5 = ☐

Phindza kabili 6

☐ + ☐ = ☐

Phindza kabili 7

☐ + ☐ = ☐

Phindza kabili 8

☐ + ☐ = ☐

Phindza kabili 9

☐ + ☐ = ☐



Phindza kabili letinombolo. Faka umbala kubhuloki kukhombisa imphendvulo yakho.

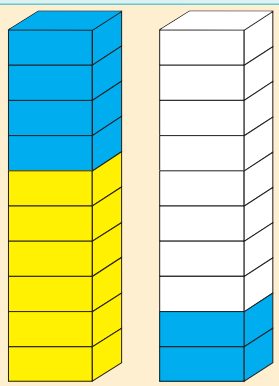

Phindza kabili 6

6 + 6 = ☐

2 × 6 = ☐

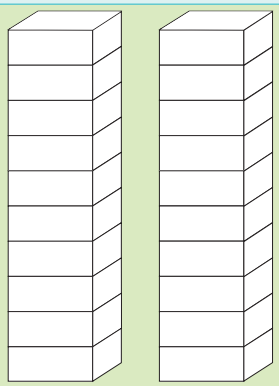

Phindza kabili 8

☐ + ☐ = ☐

2 × ☐ = ☐

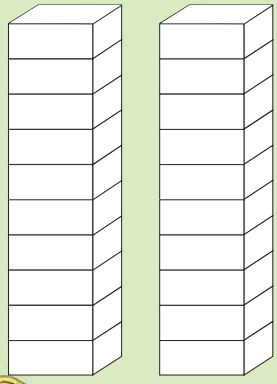

Phindza kabili 7

☐ + ☐ = ☐

2 × ☐ = ☐

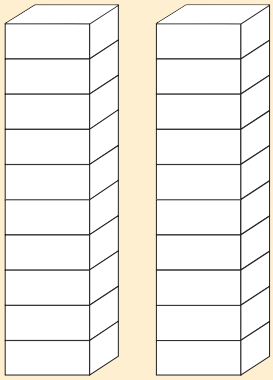

Phindza kabili 9

☐ + ☐ = ☐

2 × ☐ = ☐

Phindza loku lokulandzelako:

Phindza kabili 7	☐ + ☐ = ☐	2 × ☐ = ☐
Phindza kabili 9	☐ + ☐ = ☐	2 × ☐ = ☐
Phindza kabili 6	☐ + ☐ = ☐	2 × ☐ = ☐
Phindza kabili 8	☐ + ☐ = ☐	2 × ☐ = ☐
Phindza kabili 10	☐ + ☐ = ☐	2 × ☐ = ☐

Ngitfole emaphuzu langu 8. Umngani wami utfole laphindvwe kabili kulawami. Unamangakhi emaphuzu umngani wami?

Teacher:

Sign:

Date:

11 12 13 14 15 16 17 18 19 20

Lusuku:

Phindza kabili: siyachubeka

Phindza kabili 12



1 Biyela lobuhlalu kute uphindze kabili tinombolo. Sikucalele loku kwekucala.

Phindza kabili 13

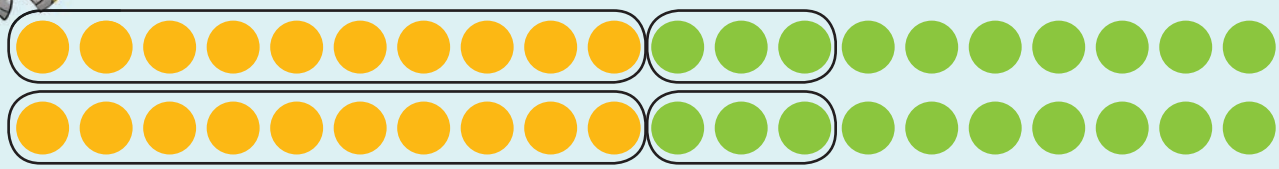

Phindza kabili 15 ☐ + ☐ = ☐



Phindza kabili 14 ☐ + ☐ = ☐



Phindza kabili 11 ☐ + ☐ = ☐



Phindza kabili 16 ☐ + ☐ = ☐



☐ + ☐ = ☐

Phindza kabili letinombolo. Faka umbala kubhuloki yemashumi lasisekelo kukhombisa imphendvulo yakho.



Phindza kabili 11

11 + 11 = ☐

2 × 11 = ☐



Phindza kabili 13

☐ + ☐ = ☐

2 × ☐ = ☐



Phindza kabili 14

☐ + ☐ = ☐

2 × ☐ = ☐



Phindza kabili 15

☐ + ☐ = ☐

2 × ☐ = ☐

Phindza loku lokulandzelako.

Phindza kabili 11	☐ + ☐ = ☐	2 × ☐ = ☐
Phindza kabili 13	☐ + ☐ = ☐	2 × ☐ = ☐
Phindza kabili 16	☐ + ☐ = ☐	2 × ☐ = ☐
Phindza kabili 17	☐ + ☐ = ☐	2 × ☐ = ☐
Phindza kabili 18	☐ + ☐ = ☐	2 × ☐ = ☐

Ngitfole emagama lali 14 kahle emdlalweni wekupela. Mphetsa utfole linani leliphindzekile kuleli lami. Ngabe utfole mangakhi emagama kahle mphetsa?

Teacher:
Sign:
Date:

11 12 13 14 15 16 17 18 19 20

Lusuku:

Kwekuphatsa nemtsamo

1 Coca ngekwekuphatsa etukwemadesiki.

2 Shano kutsi kwekuphatsa kugcwele noma kute lutfo.





3 Faka umbala kukhombisa kutsi letintfo tekuphatsa ti_____.



4 Dvweba kwakakho kwekuphatsa ufake imibala kuloko lokucuketfwe kukhombisa:

Kute lutfo	Kugcwele
Kute lutfo	Kugcwele

Teacher:
Sign:
Date:

Lusuku:

Kuphindzaphindza: × 3

1 Mangakhi emaswidi lakhona etafuleni ngalinye?

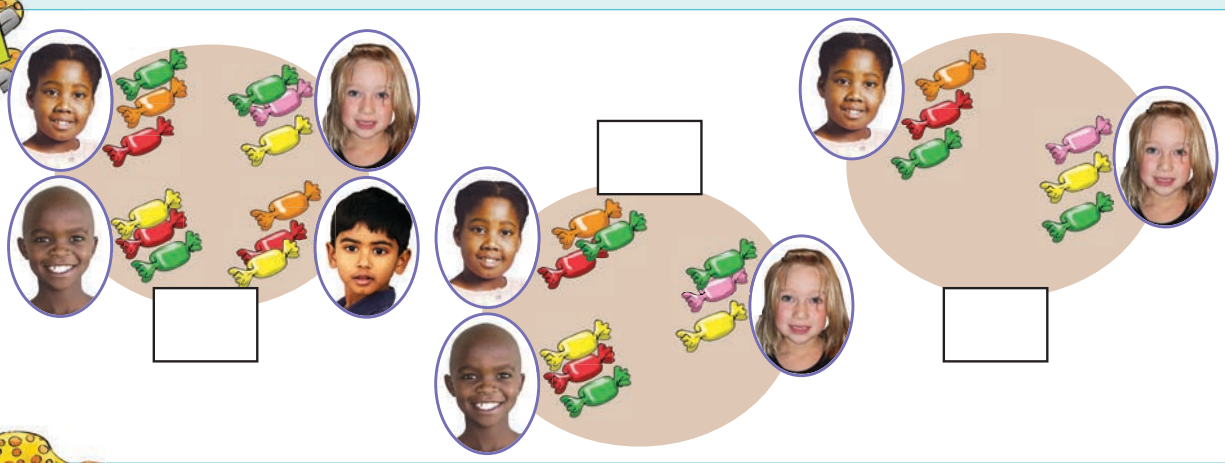

2 Cedzela loku lokulandzelako:

2 emacembu a 3	3 + 3 =	2 × 3 = ☐
5 emacembu a 3	3 + 3 + 3 + 3 + 3 =	5 × 3 = ☐
4 emacembu a 3	3 + 3 + 3 + 3 =	4 × 3 = ☐
6 emacembu a 3	3 + 3 + 3 + 3 + 3 + 3 =	6 × 3 = ☐
7 emacembu a 3	3 + 3 + 3 + 3 + 3 + 3 + 3 =	7 × 3 = ☐

3 Yenta umdvwebo waloku lokulandzelako.

3 emacembu a 3	4 emacembu a 3	5 emacembu a 3

1 2 3 4 5 6 7 8 9 10



Yenta umdvwebo waloku lokulandzelako.

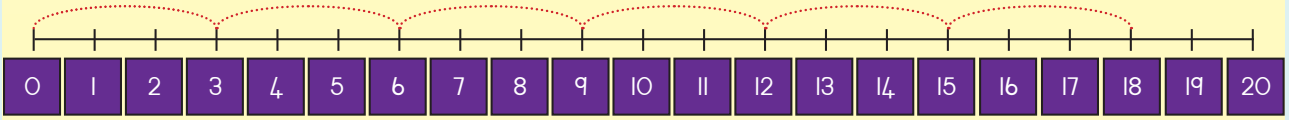

3, 6, 9, 12, ___ , ___

3 + 3 + 3 + 3 + 3 + 3= ☐

6 emacembu a ☐ = ☐

6 × 3 = ☐

Umdvwebo

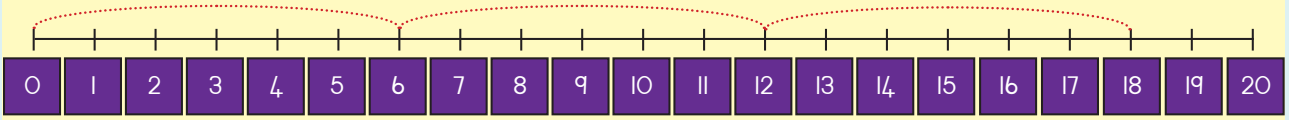

6, ___ , ___

6 + ☐ + ☐ = ☐

3 emacembu a ☐ = ☐

3 × ☐ = ☐

Umdvwebo

Libhodo lekupheka linetinyawo letintsatfu.
Ngabe emabhodo ekupheka lasi-7 anetinyawo letingakhi? ☐

3 6 9 12 15 18

21 24 27 30 33

Teacher:
Sign:
Date:

11 12 13 14 15 16 17 18 19 20

Lusuku:

Emaphethini etinombolo: ngakutsatfu

1 Ase sibale ngakutsatfu.



2 Dvweba nobe namatsisela titfombe tetintfo letita ngatintsatfu.

3 Siyicalile iphethini. Yicedzele.

1	2	3	4	5	6	7	8	9	10
11	12	13	14	15	16	17	18	19	20
21	22	23	24	25	26	27	28	29	30
31	32	33	34	35	36	37	38	39	40
41	42	43	44	45	46	47	48	49	50
51	52	53	54	55	56	57	58	59	60
61	62	63	64	65	66	67	68	69	70
71	72	73	74	75	76	77	78	79	80
81	82	83	84	85	86	87	88	89	90
91	92	93	94	95	96	97	98	99	100



4 Sebentisa lomugca-nombolo kubhala iphethini.

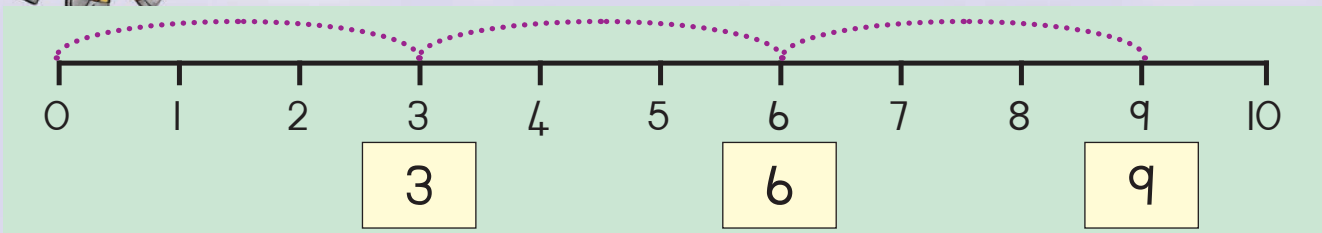

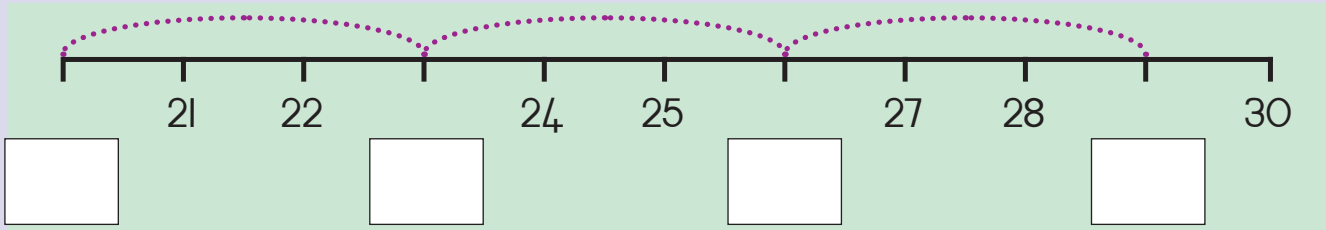

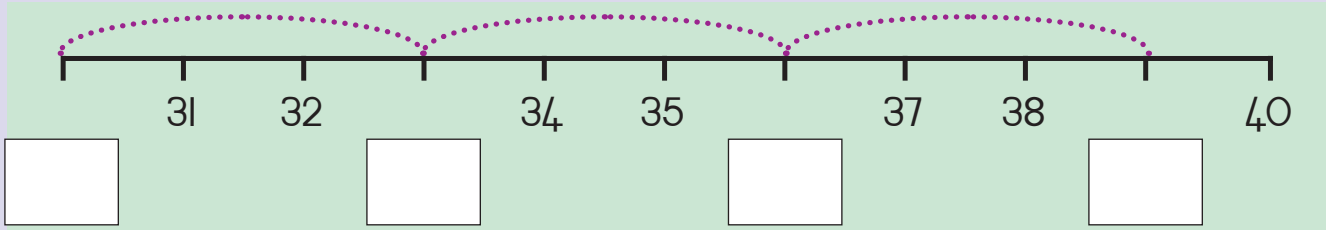

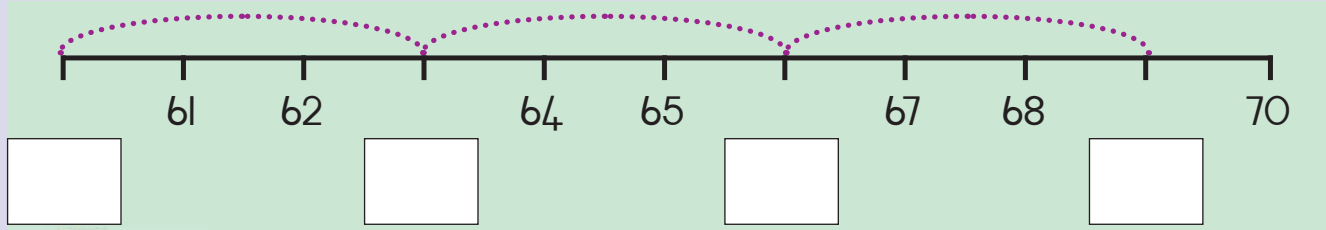

5 Cedzela loku lokulandzelako.

3, 6, 9, __ , __ , __	1, 4, 7, __ , __ , __	99, 96, 93, __ , __ , __
36, 39, 42, __ , __ , __	22, 25, 28, __ , __ , __	66, 63, 60, __ , __ , __
12, 15, 18, __ , __ , __	15, 12, 9, __ , __ , __	40, 37, 34, __ , __ , __

6 Kunabosondvo-ntsatfu labali-10 enkhulisa. Mangakhi emasondvo alabosondvo-ntsatfu lataba khona?

Teacher:
Sign:
Date:

11 12 13 14 15 16 17 18 19 20

Lusuku:

Kuphindzaphindza: × 4

1 Mangakhi emaswidi lakhona etafuleni ngalinye?



2 Cedzela loku lokulandzelako.

3 emacembu a 4	4 + 4 + 4 =	3 × 4 =
2 emacembu a 4	4 + 4 =	2 × 4 =
4 emacembu a 4	4 + 4 + 4 + 4 =	4 × 4 =
6 emacembu a 4	4 + 4 + 4 + 4 + 4 + 4 =	6 × 4 =
7 emacembu a 4	4 + 4 + 4 + 4 + 4 + 4 + 4 =	7 × 4 =

3 Yenta umdvwebo waloku lokulandzelako.

3 emacembu a 4	4 emacembu a 4	5 emacembu a 4

1 2 3 4 5 6 7 8 9 10

Yenta umdvwebo waloku lokulandzelako.

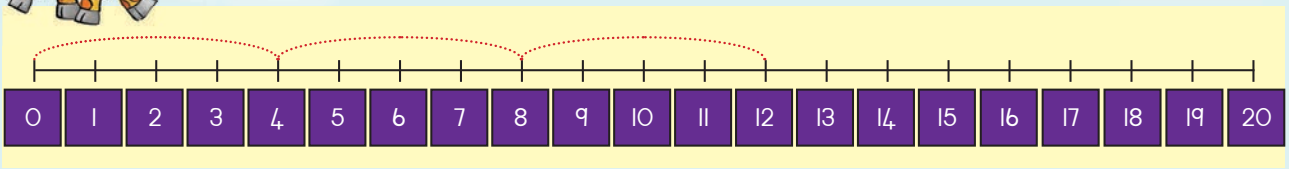

4, 8, ___

4 + 4 + 4 = ☐

3 emacembu a 4 = ☐

3 × 4 = ☐

Umdvwebo

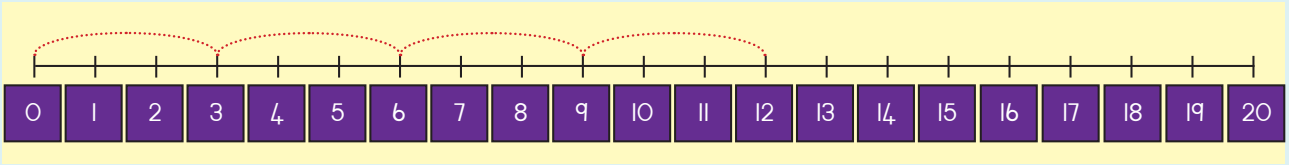

3, 6, 9, ___

3 + 3 + 3 + 3 = ☐

4 emacembu a ☐ = ☐

4 × ☐ = ☐

Umdvwebo

Lihhashi linetinyawo leti-4. Ngabe emahhashi lama-3 anetinyawo letingakhi? ☐

4 8 12 16 20 24

28 32 36 40

Teacher:

Sign:

Date:

11 12 13 14 15 16 17 18 19 20

Lusuku:

Emaphethini etinombolo: Ngakune

1 Asibaleni ngakune.





2 Dvweba nobe namatsisela titfombe tetintfo letita ngatine.

3 Siyicalile iphethini. Yicedzele.

1	2	3	4	5	6	7	8	9	10
11	12	13	14	15	16	17	18	19	20
21	22	23	24	25	26	27	28	29	30
31	32	33	34	35	36	37	38	39	40
41	42	43	44	45	46	47	48	49	50
51	52	53	54	55	56	57	58	59	60
61	62	63	64	65	66	67	68	69	70
71	72	73	74	75	76	77	78	79	80
81	82	83	84	85	86	87	88	89	90
91	92	93	94	95	96	97	98	99	100



Sebentisa lomugca-nombolo kubhala iphethini.

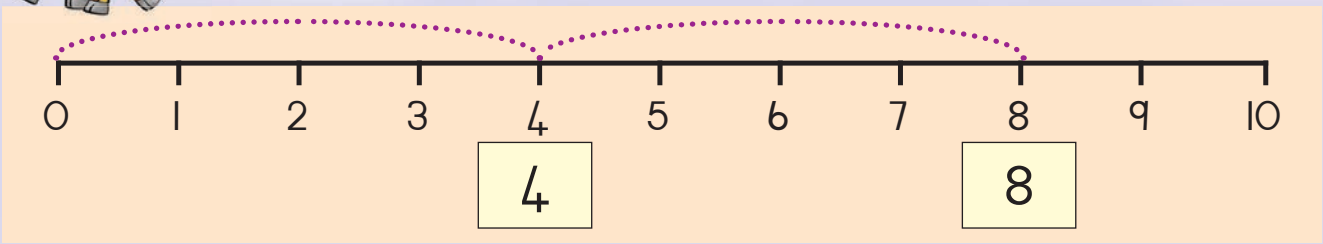

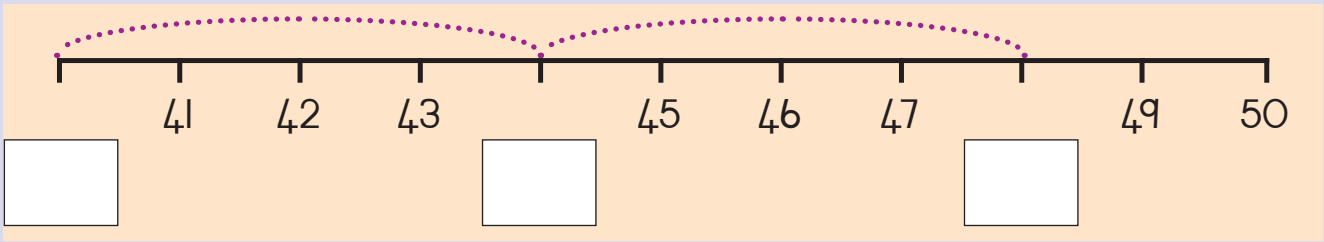

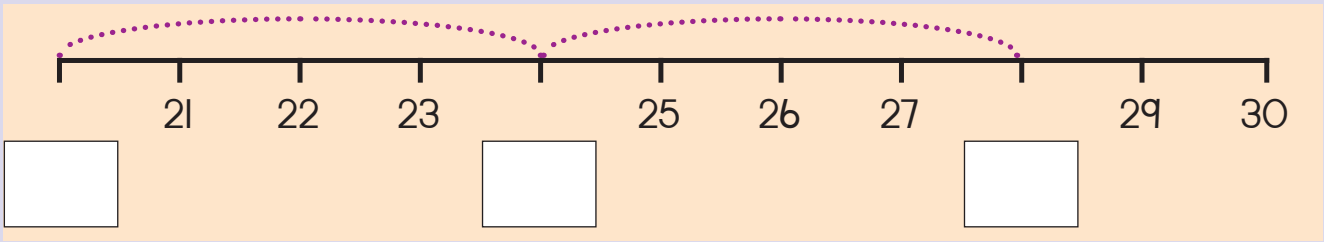

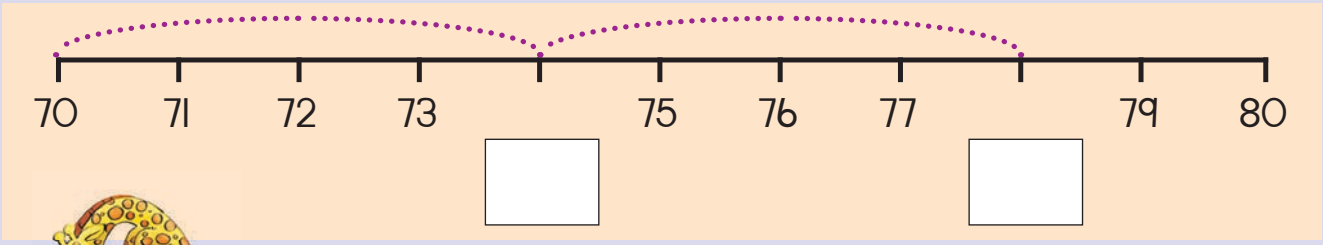

Cedzela loku lokulandzelako.

4, 8, 12, __ , __ , __	1, 5, 9, __ , __ , __	48, 44, 40, __ , __ , __
28, 32, 36, __ , __ , __	42, 46, 50, __ , __ , __	60, 56, 52, __ , __ , __
12, 16, 20, __ , __ , __	20, 16, 12, __ , __ , __	70, 66, 62, __ , __ , __

Kunemicatsane lemi-4 aphaketheni. Ngitsengise emaphakethe layi-9. Mingakhi imicatsane lengiyitsengisile?

Teacher:
Sign:
Date:

Lusuku:

Tindzaba ngekuphindzaphindza

Camba yakakho indzaba usebentisa emagama lafana nalawa: emehlo, imilente, tandla, tinyawo, tilwane, bantfu.

Likati linemehlo lama-2. Emakati lama-4 anamangakhi emehlo?



Faka umbala emehlweni elikati.

Wakhombise ngetintfo tekubala.

Wakhombise kumugca-nombolo.

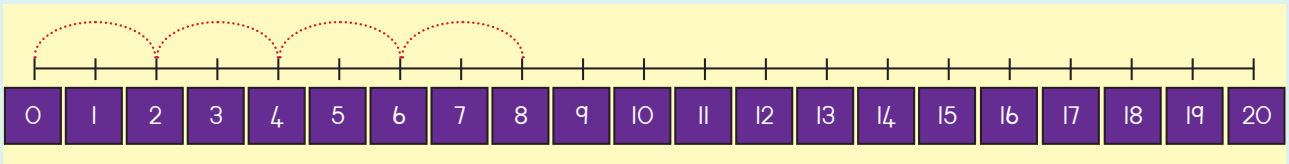

☐ + ☐ + ☐ + ☐ = ☐

☐ × ☐ = ☐



Libhayisikili linemasondvo lama-3. Ngabe emabhayisikili emasondvo lamatsatfu lasi-5 anemasondvo lamangakhi?

Faka umbala emasondvweni.

Khombisa ngetintfo tekubala.

Khombisa kumugca-nombolo.

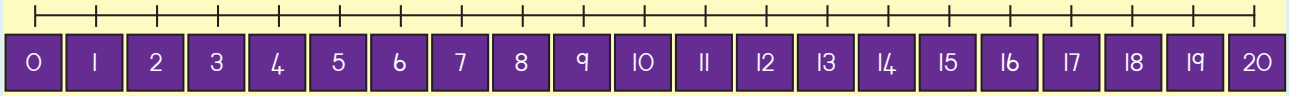

+ = ☐ ☐ × ☐ = ☐

Inja inetinyawo leti-4. Ngabe tinja leti-4 tinetinyawo letingakhi?



Faka umbala kuletinyawo taletinja.

Khombisa ngetintfo tekubala.

Khombisa kumugca-nombolo.

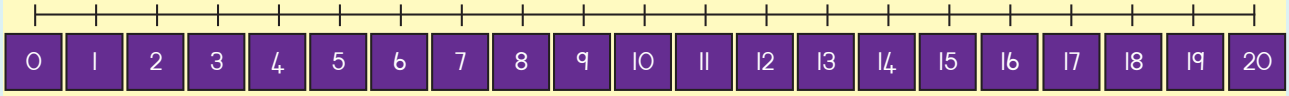

+ = ☐ ☐ × ☐ = ☐

Teacher:
Sign:
Date:

Lusuku:

Ema-awa

1 Coca ngeliwashi.

Lutsi lolufisha lusikhombisa ema-awa.
Lapha lusikhombisa 7 wema-awa.

Lutsi ewashini luhamba lugegelete futsi lugegelete, Lugegelete futsi lugegelete, lugegelete futsi lugegelete. Lutsi ewashini luhamba lugegelete futsi lugegelete, Kusatisa sikhatsi.

2 Lutsi lolufisha lusikhombisani?

☐ li-awa

☐ ema-awa

☐ ema-awa

☐ ema-awa

☐ ema-awa

☐ ema-awa

☐ ema-awa

☐ ema-awa

☐ ema-awa

☐ ema-awa

☐ ema-awa

☐ ema-awa



3 Dvweba lutsi lolufisha.

4 ema-awa

1 li-awa

11 ema-awa

7 ema-awa

9 ema-awa

10 ema-awa

2 ema-awa

5 ema-awa

3 ema-awa

6 ema-awa

8 ema-awa

12 ema-awa

4 Yini lengatsatsa li-awa lonkhe kuyenta? Faka umbala imphendvulo lengiyo.

Wenta umsebenti wesikolo ekhaya

Ulele

Ucubha ematinyo

Teacher:
Sign:
Date:

Lusuku:

Emaphethini etinombolo: ngesihlanu

1 Asibaleni ngesihlanu.





2 Dvweba nobe namatsisela titfombe tetintfo letita ngatinhlanu.

3 Siyicalile iphethini. Yicedzele.

1	2	3	4	5	6	7	8	9	10
11	12	13	14	15	16	17	18	19	20
21	22	23	24	25	26	27	28	29	30
31	32	33	34	35	36	37	38	39	40
41	42	43	44	45	46	47	48	49	50
51	52	53	54	55	56	57	58	59	60
61	62	63	64	65	66	67	68	69	70
71	72	73	74	75	76	77	78	79	80
81	82	83	84	85	86	87	88	89	90
91	92	93	94	95	96	97	98	99	100

Sebentisa lomugca-nombolo kubhala iphethini.

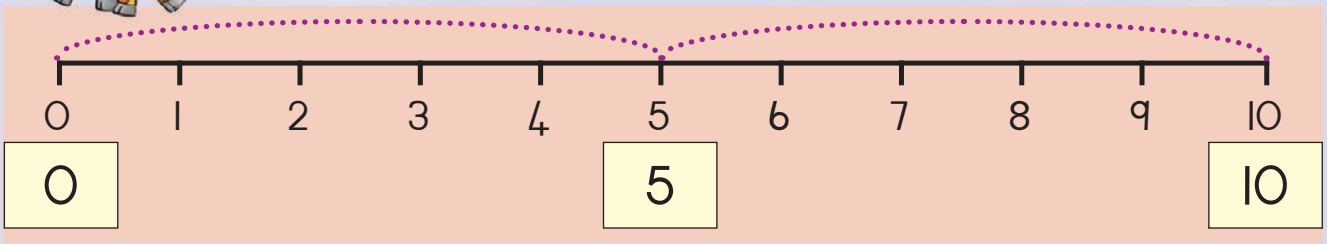

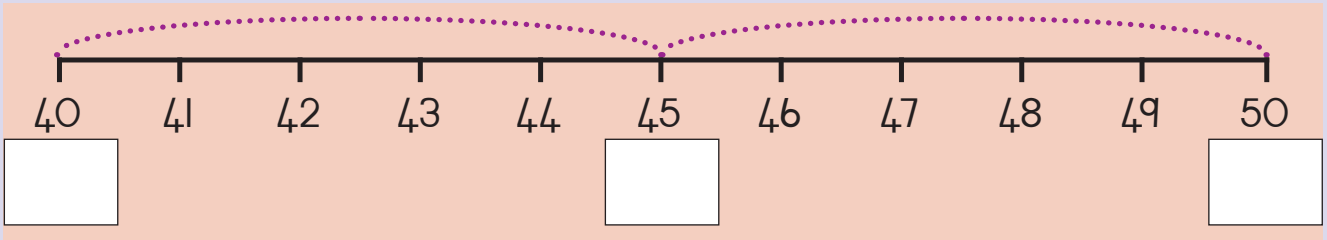

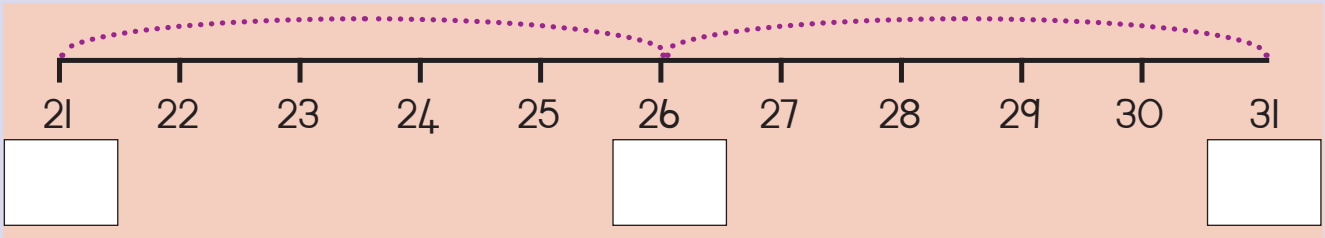

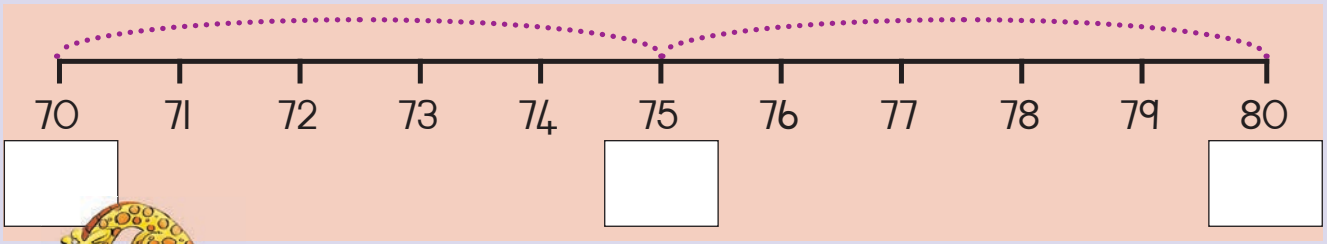

Cedzela loku lokulandzelako.

5, 10, 15, __ , __ , __	1, 6, 11, __ , __ , __	50, 45, 40, __ , __ , __
20, 25, 30, __ , __ , __	23, 28, 33, __ , __ , __	60, 55, 50, __ , __ , __
30, 35, 40, __ , __ , __	25, 20, 15, __ , __ , __	54, 49, 44, __ , __ , __

5 10 15 20 25 30 35 40 45 50

Teacher:
Sign:
Date:

11 12 13 14 15 16 17 18 19 20

Lusuku:

Imizuzu

1 Siyisebentisa kanjani imigca lemnyama lemifisha lesewashini?



2 Gcwalisa lemizuzu.

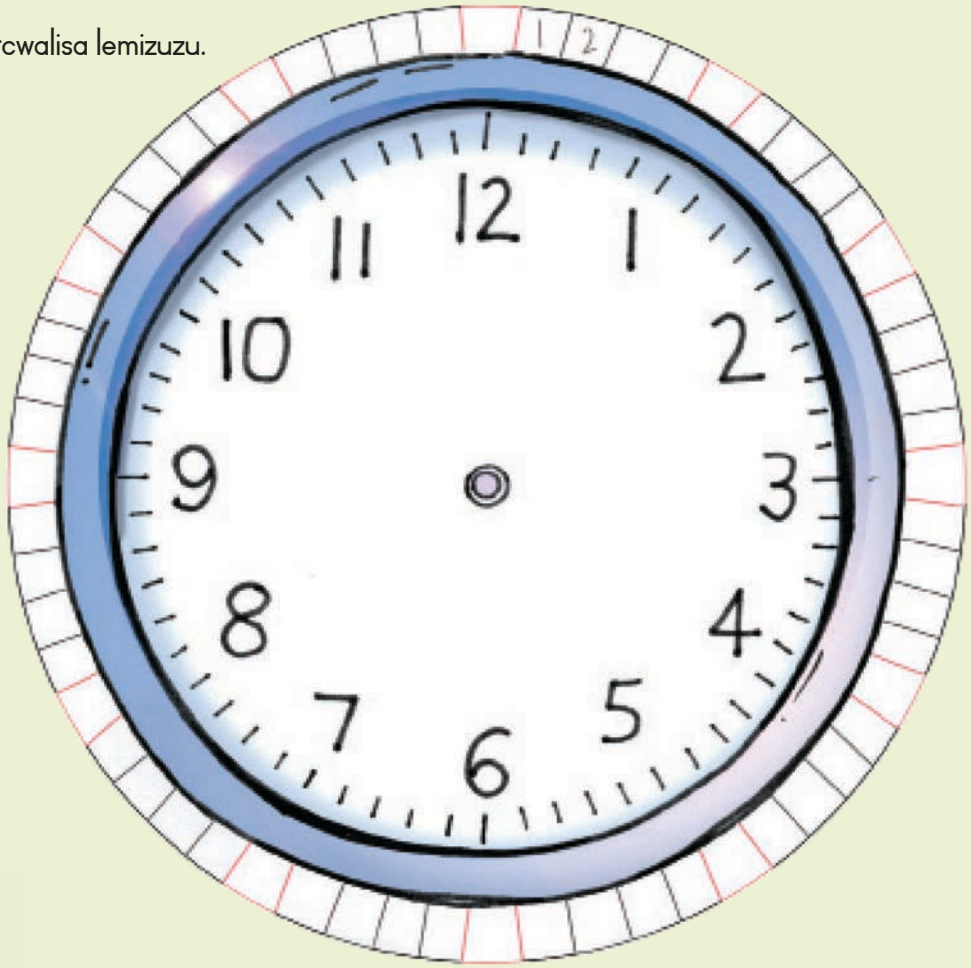

3 Bhala phansi letinombolo letisetikweleni letibovu lapha.

1 2 3 4 5 6 7 8 9 10

Yenta umdvwebo wetintfo longatenta ngalesikhatsi . . .

1 umzuzu	5 wemizuzu
30 wemizuzu	60 wemizuzu

Teacher:
Sign:
Date:

11 12 13 14 15 16 17 18 19 20

Lusuku:

Siyachubeka ngemizuzu

1 Coca ngeliwashi.

Lutsi loludze lusikhombisa imizuzu.
Lapha lusikhombisa 10 wemizuzu.

Lutsi ewashini luhamba lugegelete futsi lugegelete, Lugegelete futsi lugegelete, lugegelete futsi lugegelete. Lutsi ewashini luhamba lugegelete futsi lugegelete.
Kusatisa sikhatsi.

2 Ngabe lutsi loludze lusikhombisani?

☐ imizuzu

☐ imizuzu

☐ imizuzu

☐ imizuzu

☐ imizuzu

☐ imizuzu



Dvweba lutsi loludze.

55 imizuzu

35 imizuzu

60 imizuzu

10 imizuzu



45 imizuzu

12 imizuzu

Yini lengatsatsa umzuzu munye kuyenta? Faka umbala emphendvulweni lengiyo.

Uyazuba

Uyadlala

Uyadla

Teacher:
Sign:
Date:

11 12 13 14 15 16 17 18 19 20

Lusuku:

Kubeka ngemacembu nekwabelana

1 Mangakhi emabhuloki lakhona endilingeni ngayinye? Wabe ngekulingana emkhatsini webantfwana.



2 Mangakhi emabhuloki kundilinga ngayinye? Bhala ithothali kundilinga lelingangane.

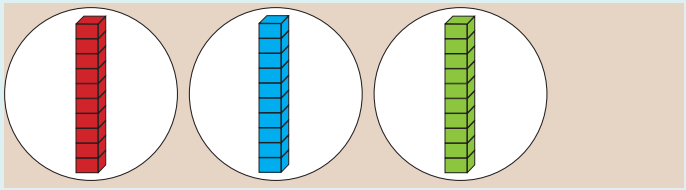

☐ × ☐ = ☐

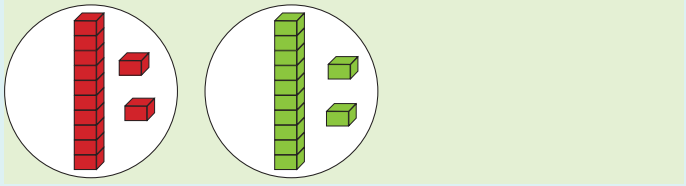

☐ × ☐ = ☐

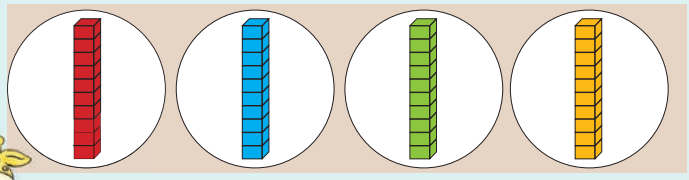

☐ × ☐ = ☐

3 Yaba emabhuloki ngekulingana emkhatsini waletindilinga.

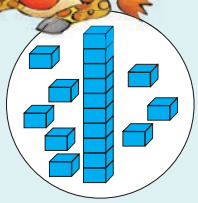

☐ kwabiwe emkhatsini wa ☐ = ☐



☐ kwabiwe emkhatsini wa ☐ = ☐

Dvweba loku lokulandzelako. Bhala sibalo sakunye.

3 emacembu a 2

+ Sibalo sekuhlanganisa:

× Sibalo sekuphindzaphindza:

2 emacembu a 14

+ Sibalo sekuhlanganisa:

× Sibalo sekuphindzaphindza:

Yaba tintfo tekubala letili- 12 emkhatsini kwa 4.

− Sibalo sekukhipha:

÷ Kwabiwe emkhatsini wesibalo (sekwehlukanisa):

Yaba tintfo tekubala letingema- 30 emkhatsini kwa 3.

− Sibalo sekukhipha:

÷ Kwabiwe emkhatsini wesibalo (sekwehlukanisa):

Kubala.

2 emacembu a 7 _____ 3 emacembu a 8 _____

4 emacembu a 5 _____ 2 emacembu a 15 _____

Yaba 18 nga 2 _____ Yaba 24 nga 3 _____

Yaba 35 nga 5 _____ Yaba 50 nga 10 _____

Bekunemacembu lasi-6 abo 5 edzilini lami. Bebabangakhi labantfwana kulelidzili lami?

Teacher:

Sign:

Date:

11 12 13 14 15 16 17 18 19 20

Lusuku:

Siyachubeka nekubutsanisa nekwaba

1 Mangakhi emabhuloki lakhona endilingeni ngayinye? Wabe ngekulingana emkhatsini webantfwana.



2 Tingakhi tintfo tekubala kundilinga ngayinye?
Bhala ithothali kundilinga lelingangane.

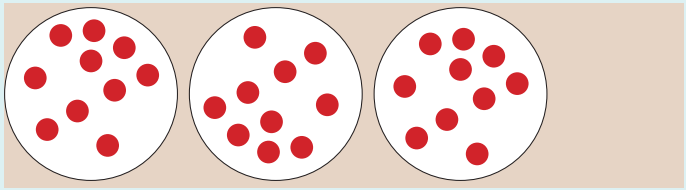

☐ × ☐ = ☐



☐ × ☐ = ☐

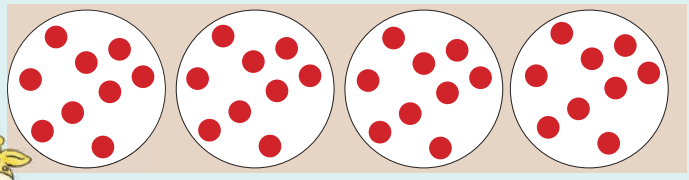

☐ × ☐ = ☐

3 Hlukanisa letintfo tekubala emkhatsini wetindilinga.

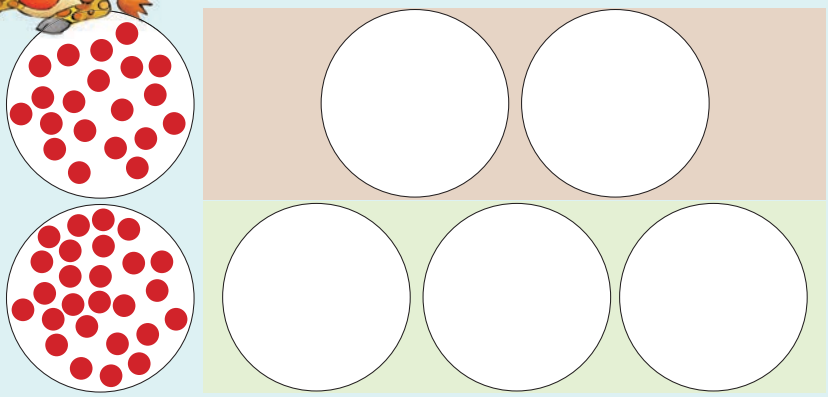

☐ kwabiwe emkhatsini wa ☐ = ☐

☐ kwabiwe emkhatsini wa ☐ = ☐

Dvweba loku lokulandzelako. Bhala sibalo sakunye.

3 emacembu a 12

+ Sibalo sekuhlanganisa:

× Sibalo sekuphindzaphindza:

5 emacembu a 10

+ Sibalo sekuhlanganisa:

× Sibalo sekuphindzaphindza:

Yaba tintfo tekubala letingu 24 emkhatsini kwa 4

− Sibalo sekukhipha:

÷ Kwabiwe emkhatsini wesibalo (sekwehlukanisa):

Yaba tintfo tekubala letingu 25 emkhatsini kwa 5.

− Sibalo sekukhipha:

÷ Kwabiwe emkhatsini wesibalo (sekwehlukanisa):

Kubala.

2 emacembu a 11 _____

3 emacembu a 10 _____

4 emacembu a 4 _____

2 emacembu a 25 _____

Yaba 20 nga 2 _____

Yaba 27 nga 3 _____

Yaba 50 nga 5 _____

Yaba 28 nga 2 _____

Kuphindza kabili yaba

Teacher:
Sign:
Date:

11 12 13 14 15 16 17 18 19 20

Lusuku:

Asichubeke nekubutsanisa nekwaba

1 Tingakhi tintfo tekubala kundilinga ngayinye? Tabe ngekulingana emkhatsini webantfwana lababili.



2 Tingakhi tintfo tekubala kundilinga ngayinye?

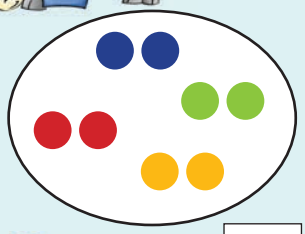



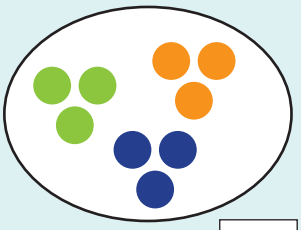

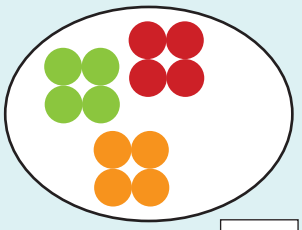

3 Juba bobunjwa kuLokujutjiwe 4 bese ubanamatsisela kubhuloki lefanele. Bala bobunjwa.

4 Yabela bantfwana labobunjwa. Sebentisa labobunjwa kuLokujutjiwe 4.
(Lishadi lekusebentela 60 sigaba)

bocalantsatfu

tikwele

5 Yabela bantfwana lesitselo. Sidvwebe.

emawolintji

emahhabhula

6 BoJJohn naBelinda babelane 12 wemaswidi ngalokulinganako. Amunye utfole mangakhi?

Teacher:
Sign:
Date:

11 12 13 14 15 16 17 18 19 20

Lusuku:

Kubutsanisa nekwabelana

1 Bungakhi buhlalu lobubalako kundilinga ngayinye? Babele bantfwana.

2 Bungakhi buhlalu kundilinga ngayinye?

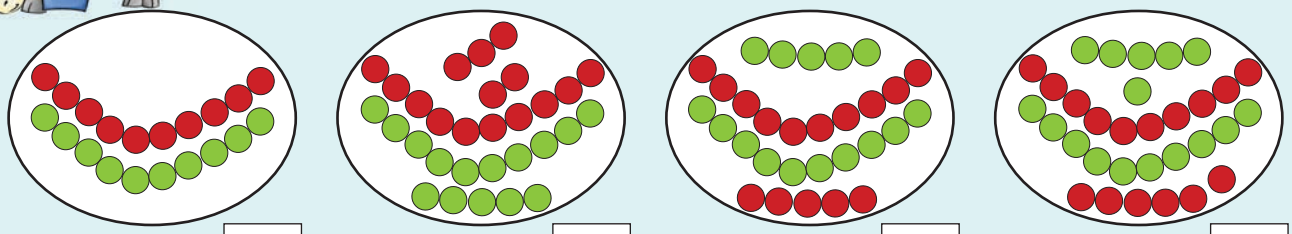

3 Juba lobuhlalu kuLokujutjiwe 4 (Lishadi lekusebentela 61 sigaba) bese ubunamatsisela lapha. Bala lobuhlalu.

Buhlalu lobubovu	Buhlalu lobulingangane
Buhlalu lobumtfubi	Buhlalu lobuluhlata



4 Dvweba linani lelilinganako lebuhlalu bemntfwana ngamunye.

5 Yaba lobuhlalu wabele bantfwana. Budvwebe.

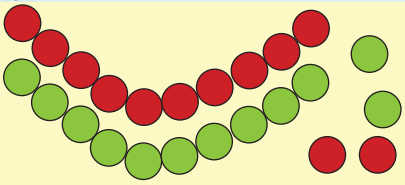

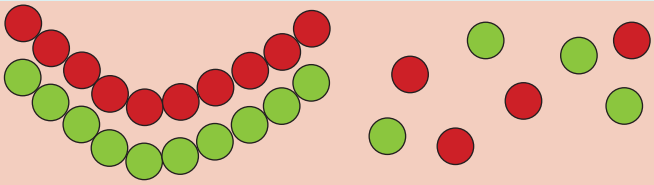

6 Busi naZaheda babelane 32 wemapeniseli lanemibala ngalokulinganako. Amunye utfole mangakhi?

Teacher:
Sign:
Date:

Lusuku:

Bohhafu: 1 – 20

Yini leyentekile kumahhabhula?



Yaba titselo letingesancele emabhasikidini langesekudla. Tidvwebe.

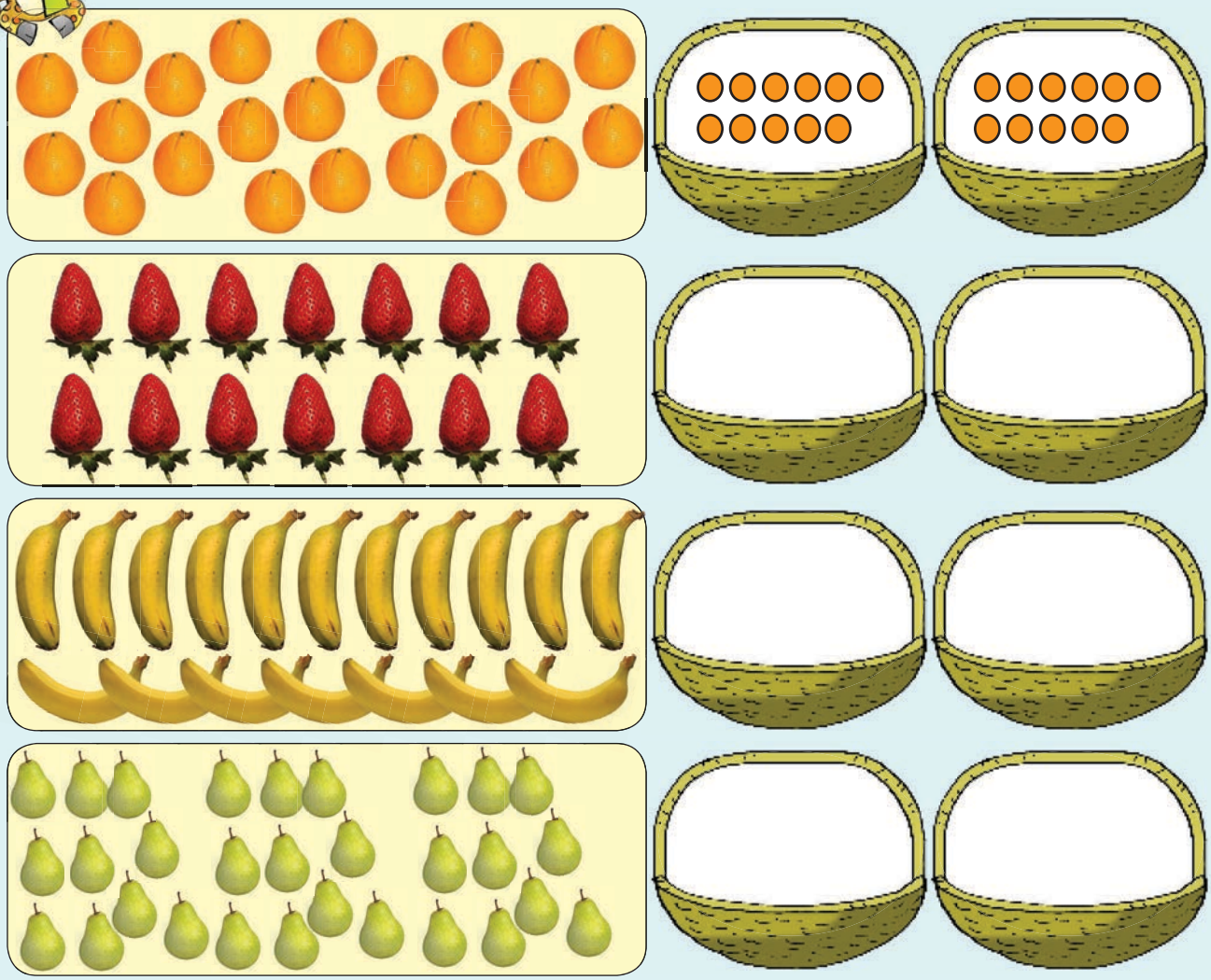



2 Dvweba umugca kukhombisa ihhafu.

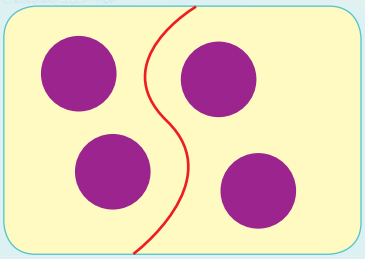

Ihhafu ya 4 ngu 2



Ihhafu ya 6 ngu



Ihhafu ya 8 ngu



Ihhafu ya 2 ngu

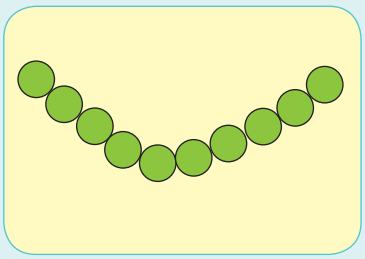

Ihhafu ya 10 ngu

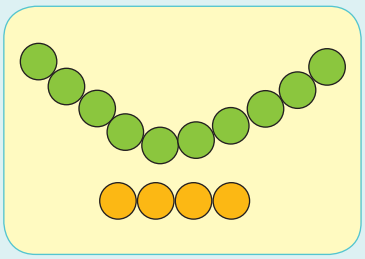

Ihhafu ya 14 ngu

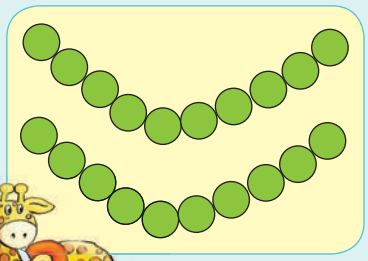

Ihhafu ya 20 ngu

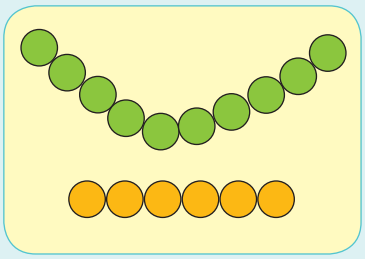

Ihhafu ya 16 ngu

3 Yini ihhafu yelipulede ngalinye lekudla?

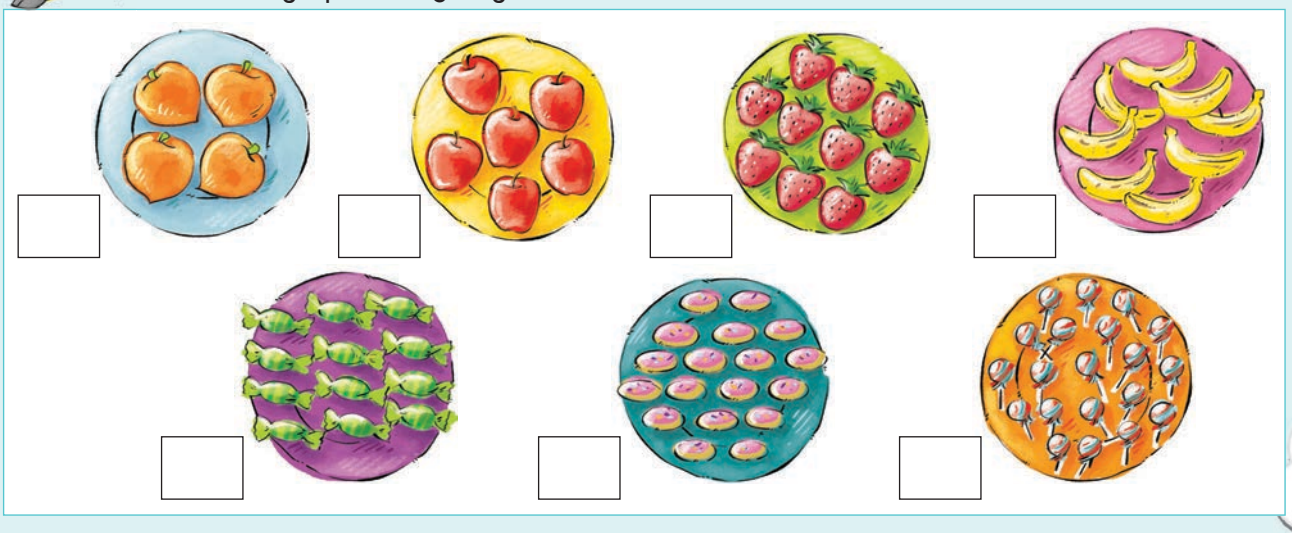

Teacher:
Sign:
Date:

Lusuku:

Kwabelana 20 – 50

1 Tjela umngani wakho kutsi lobuhlalu babiwe njani kuletindishi letimbili.





2 Yaba lobuhlalu lobungesancele emabhasikidini langesekudla ngalokulinganako.
Budvwebe usabufaka ebhasikidini.

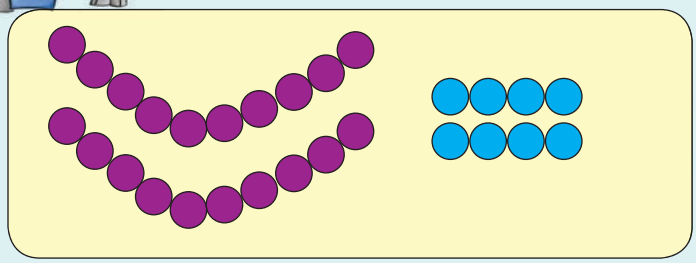

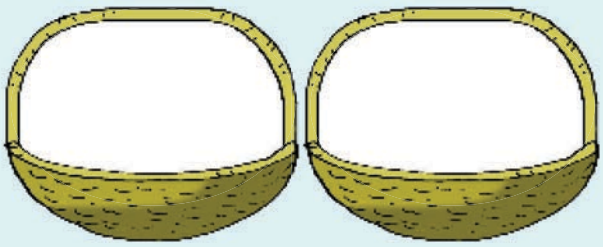

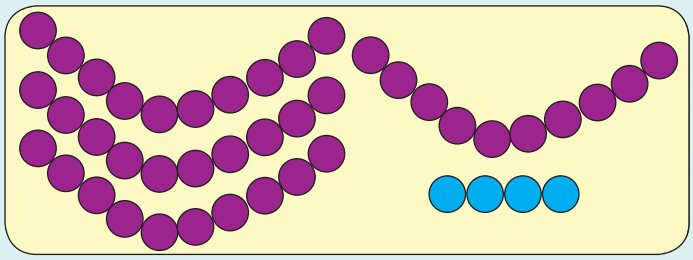



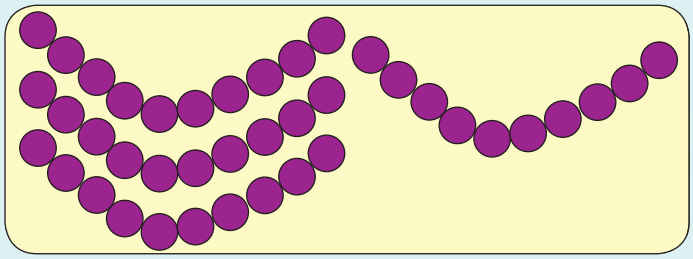



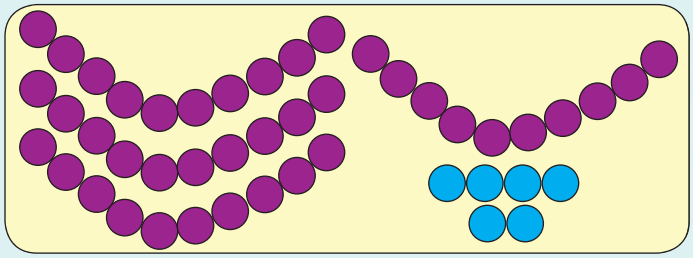





Faka umbala lohlukile ehhafini yaloku.

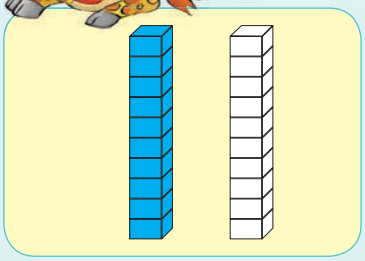

Ihhafu ya 20 ngu 10

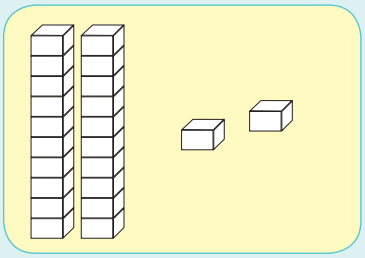

Ihhafu ya 22 ngu

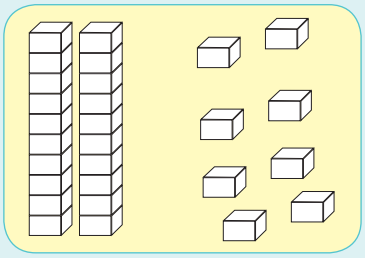

Ihhafu ya 28 ngu

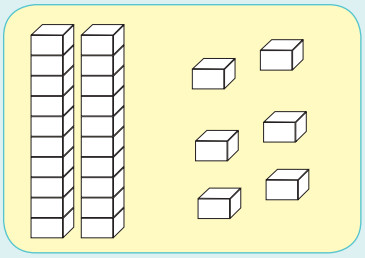

Ihhafu ya 26 ngu

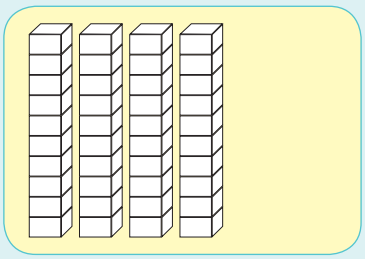

Ihhafu ya 40 ngu

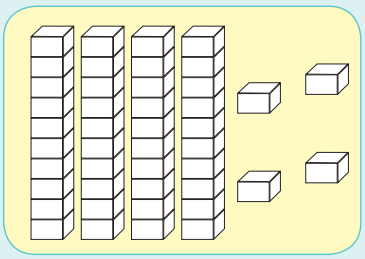

Ihhafu ya 44 ngu

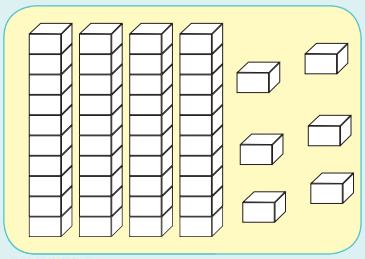

Ihhafu ya 46 ngu

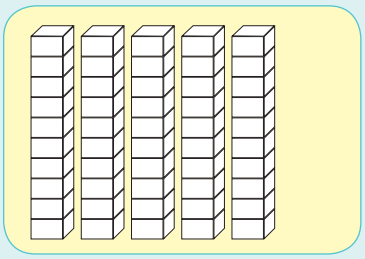

Ihhafu ya 50 ngu

Faka umbala kuhhafu yedayagramu ngayinye.

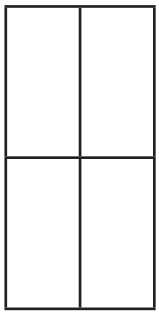

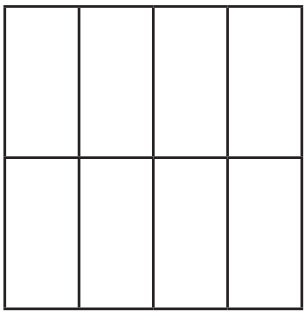

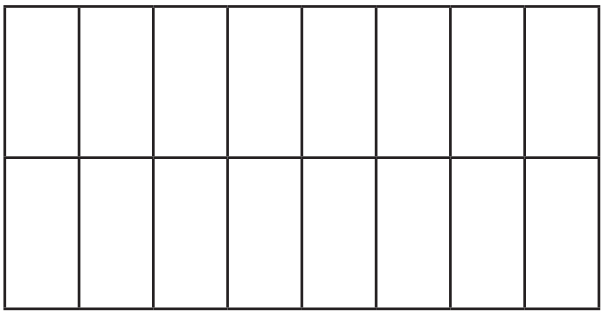

Teacher:
Sign:
Date:

11 12 13 14 15 16 17 18 19 20

Lusuku: .....

Imininingwane

1 Hlunga letitselo. Yenta wakakho umdvwebo kukhomba loku. Bhala samba (ithothali) ebhokisini.

2 Dvweba sitfombe-mdvwebo setitselo takho letihlungiwe.



3 Buka letitselo bese uphendvula imibuto.



Ngusiphi sitselo lesinaso kakhulu?

Ngusiphi sitselo lesinaso kancane?

Teacher:
Sign:
Date:

1 2 3 4 5 6 7 8 9 10 11 12 13 14 15 16 17 18 19 20

Lokujutjiwe 1

Lishadi lekusebentela 10 na 40



Lishadi lekusebentela 13

ekuseni kakhulu	imini yatsambama	intsambama
busuku	ekhatsi nebusuku	ekuseni nasemva kwemadina

Lokujutjiwe 2

Lishadi lekusebentela 22

Imicimbi yemlandvo

Lilanga lemalungelo ebantfu	Lilanga lekucolelana	Lilanga lebasebenti
Lilanga lebantfu labasha	Lilanga lemagugu	Lilanga labomake lavelonkhe
	Lilanga lenkhululeko	

Timphawu taletinkholo



Bhahayi	BuJuda	BuBhuda	BuMozilemu	BuKhrestu	Indzabuko yesiNtfu	BuHindu

Cut-out 3

Worksheets 25 and 26

R50	R50	R50	R50	R50
R10	R10	R10	R10	R10
R20	R20	R20	R20	R20
R100	R100	R100	R100	R100
R50	R50	R50	R50	R50
R10	R10	R10	R10	R10
R20	R20	R20	R20	R20
R100	R100	R100	R100	R100

Cut-out 4

Worksheet 27



Worksheet 60




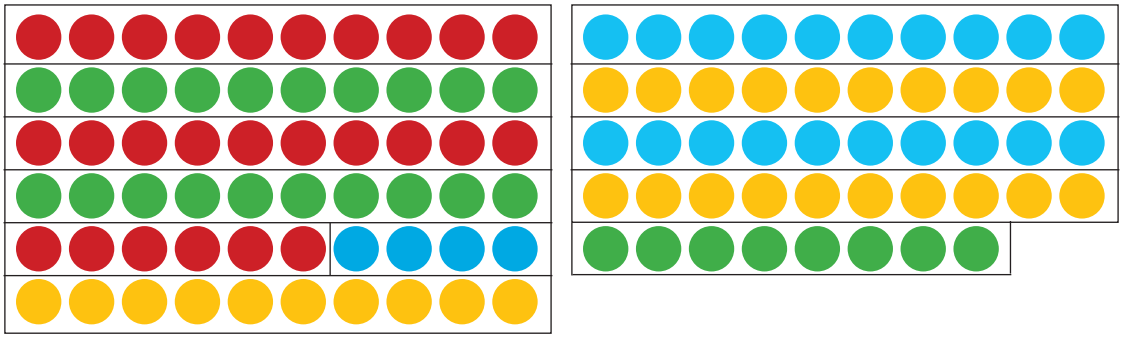
Worksheet 61