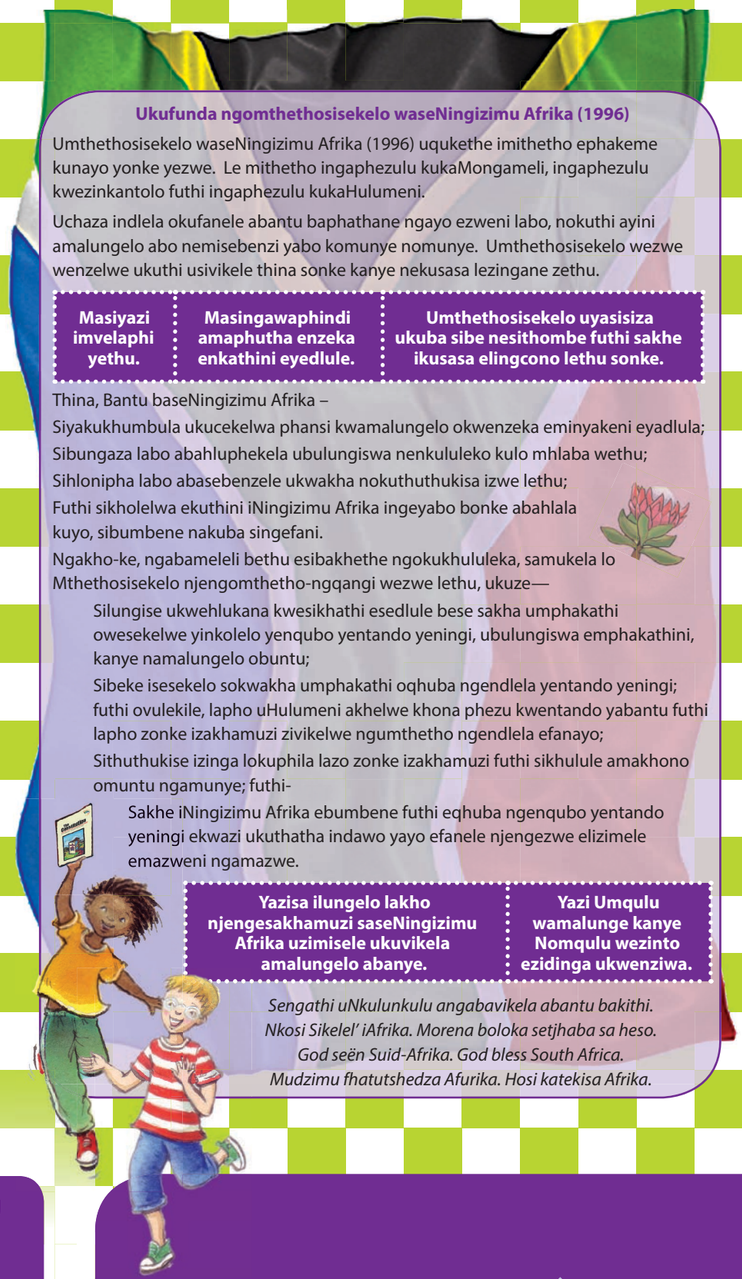

Ukufunda ngomthethosisekelo waseNingizimu Afrika (1996)

Umthethosisekelo waseNingizimu Afrika (1996) uqukethe imithetho ephakeme kunayo yonke yezwe. Le mithetho ingaphezulu kukaMongameli, ingaphezulu kwezinkantolo futhi ingaphezulu kukaHulumeni.

Uchaza indlela okufanele abantu baphathane ngayo ezweni labo, nokuthi ayini amalungelo abo nemisebenzi yabo komunye nomunye. Umthethosisekelo wezwe wenzelwe ukuthi usivikele thina sonke kanye nekusasa lezingane zethu.

Masiyazi imvelaphi yethu.	**Masingawaphindi amaphutha enzeka enkathini eyedlule.**	**Umthethosisekelo uyasisiza ukuba sibe nesithombe futhi sakhe ikusasa elingcono lethu sonke.**

Thina, Bantu baseNingizimu Afrika –

Siyakukhumbula ukucekelwa phansi kwamalungelo okwenzeka eminyakeni eyadlula;

Sibungaza labo abahluphekela ubulungiswa nenkululeko kulo mhlaba wethu;

Sihlonipha labo abasebenzele ukwakha nokuthuthukisa izwe lethu;

Futhi sikholelwa ekuthini iNingizimu Afrika ingeyabo bonke abahlala kuyo, sibumbene nakuba singefani.

Ngakho-ke, ngabameleli bethu esibakhethe ngokukhululeka, samukela lo Mthethosisekelo njengomthetho-ngqangi wezwe lethu, ukuze—

Silungise ukwehlukana kwesikhathi esedlule bese sakha umphakathi owesekelwe yinkolelo yenqubo yentando yeningi, ubulungiswa emphakathini, kanye namalungelo obuntu;

Sibeke isesekelo sokwakha umphakathi oqhuba ngendlela yentando yeningi; futhi ovulekile, lapho uHulumeni akhelwe khona phezu kwentando yabantu futhi lapho zonke izakhamuzi zivikelwe ngumthetho ngendlela efanayo;

Sithuthukise izinga lokuphila lazo zonke izakhamuzi futhi sikhulule amakhono omuntu ngamunye; futhi-

Sakhe iNingizimu Afrika ebumbene futhi eqhuba ngenqubo yentando yeningi ekwazi ukuthatha indawo yayo efanele njengezwe elizimele emazweni ngamazwe.

Yazisa ilungelo lakho njengesakhamuzi saseNingizimu Afrika uzimisele ukuvikela amalungelo abanye.	**Yazi Umqulu wamalunge kanye Nomqulu wezinto ezidinga ukwenziwa.**

Sengathi uNkulunkulu angabavikela abantu bakithi.
Nkosi Sikelel' iAfrika. Morena boloka setjhaba sa heso.
God seën Suid-Afrika. God bless South Africa.
Mudzimu fhatutshedza Afurika. Hosi katekisa Afrika.

ISBN 978-1-920458-96-6

Rainbow WORKBOOKS

MATHEMATICS IN ISIZULU
GRADE 2 – BOOK 1
TERMS 1 & 2
ISBN 978-1-920458-96-6
THIS BOOK MAY NOT BE SOLD.
9th Edition

1 2 3 4

IZIBALO NGESIZULU – IBanga lesi- 2 Incwadi yoku-1

ISBN 978-1-920458-96-6



Ibuyekeziwe - lhambisana ne-CAPS

IBanga lesi- 2

Igama:

Iklasi:

basic education
Department:
Basic Education
REPUBLIC OF SOUTH AFRICA

IZIBALO NGESIZULU

Incwadi yoku-1

Ithemu 1 & 2

Isihlalo sabakhubazekile

No.	Isihloko	Ikhasi
1	Mina nomndeni wami	2
2	Ukubala	4
3	Izinombolo	6
4	Izinombolo ziyaqhutshwa	8
5	Ukuhlanganisa nokususa	10
6	Ukwahlukaniselana nemali	12
7	Amaphethini	14
8	Izimo	16
9	Amabhola namabhokisi	18
10	Ubude	20
11	Isisindo	22
12	Umthamo	24
13	Isikhathi	26
14	Ikhalenda lezinsuku zokuzalwa	28
15	Qoqa uhlele	30
16	Funda uhumushe	32
17	Ngaphambili, emva, phakathi	34
18	Izinombolo 1 – 30	36
19	Imigqa yezinombolo	38
20	Eminye imigqa yezinombolo	40
21	Ukuhlanganisa nokususa	42
22	Izinsuku, amasonto, izinyanga	44
23a	Ukuhlanganisa	46
23b	Ukususa	48
24	Kuyaqhutshekwa nokuhlanganisa	50
25	Imali	52
26	Imali yamaphepha	54
27	Amaphethini	56
28	Amaphethini ayaqhutshwa	58
29	Ukuphindaphinda: × 2	60
30	Ukuphindaphinda: × 5	62
31	Izindaba zokukuphindaphinda	64
32	Izinto ezingonhlangothi-ntathu	66
33	Landelanisa uphinde uqhathanise izinombolo: 1 – 40	68
34	Landelanisa uphinde uqhathanise izinombolo: 40 – 50	70
35	Izinombolo 40 – 50	72
36	Izikwele, onxande, onxantathu neziyingi	74
37	Izimpawu eziningi zezibalo 1 – 20	76
38	Izimpawu eziningi zezibalo 20 – 50	78
39a	Ukuhlanganisa	80
39b	Okunye ukuhlanganisa (kuyaqhutshwa)	82
40	Ubude	84
41	Ukususa	86
42a	Okunye ukususa	88
42b	Okunye futhi ukususa	90
43	Kuyasinda kulula	92
44	Amaphethini ezinombolo: Okuhamba ngakubili	94
45	Ukuphinda kabili	96
46	Phinda kabili futhi	98
47	Phinda kabili	100
48	Ukuphinda kabili kuyaqhutshwa	102
49	Izitsha nomthamo	104
50	Ukuphindaphinda: × 3	106
51	Amaphethini ezinombolo: Okungakuthathu	108
52	Ukuphindaphinda: × 4	110
53	Amaphethini ezinombolo: Okuhamba ngakune	112
54	Izindaba zokuphindaphinda ziyaqhutshwa	114
55	Amahora	116
56	Amaphethini ezinombolo: Okuhamba ngakuhlanu	118
57a	Imizuzu	120
57b	Imizuzu iyaqhutshwa	122
58	Ukwenza amaqoqo nokwahlukaniselana	124
59	Ukwenza amaqoqo nokuhlukaniselana kuyaqhutshwa	126
60	Okunye futhi ngokwenza amaqoqo nokwahlukaniselana	128
61	Siyaphinda ngokwakha amaqoqo nokwahlukaniselana	130
62	Ohhafu: 1 – 20	132
63	Ukwahlukaniselana 20 – 50	134
64	Imininingwane	136
	Okusikwayo koku-1	
	Okusikwayo kwesi-2	





UNkk Angie Motshekga, uNgqongqoshe weMfundo eyiSesekelo



UMnu Enver Surty, iSekela loMnyango weMfundo eyiSesekelo

Lezi zincwadi zokusebenzela zenzelwe abantwana baseNingizimu Afrika ngaphansi kwesandla sikaNgqongqoshe weMfundo eyiSesekelo, uNkk Angie Motshekga, neSekela likaNgqongqoshe weMfundo eyiSesekelo, uMnu Enver Surty.

Lezi zincwadi ezibizwa ngeRainbow Workbooks ziyingxenye yoMnyango weMfundo eyiSesekelo lapho uMnyango uzama khona ukungenelela ukuze kuthuthukiswe imfundo yabantwana bamabanga asuka kwelokuqala kuya kwelesithupha eNingizimu Afrika. UMnyango weZimali uxhase lo mkhankaso kaHulumeni njengento yokuqala uHulumeni azibekele yona ukuthi ayisukumele. Uxhaso loMnyango weZimali lusize uMnyango wezeMfundo ukuthi ukwazi ukukhiqiza uphinde usabalalise ngaphandle kwenkokhelo lezi zincwadi zokusebenzela ngazo zonke izilimi zaseNingizimu Afrika ezisemthethweni.

Sinethemba lokuthi othisha bazozithanda basebenze kangcono ngazo lezi zincwadi ekufundiseni kwabo kwansuku zonke, baphinde bathole futhi isiqiniseko sokuthi abafundi babo bafundiswa konke abamelwe ukufundiswa khona njengoba kuvela kusilabhasi yabo. Sizamile ukuqiniseka ukuthi sifaka izithonjana (ama-icon) emisebenzini yokwenziwa ukuze uthisha akuthole kulula ukuyilandela nokuqonda ukuthi umfundi yini alindeleke ukuyenza.

Sinethemba futhi lokuthi abantwana uqobo lwabo bazokujabulela ukusebenzisa lezi zincwadi ekukhuleni kwabo bakhule nolwazi eziluqukethe, bese kuthi wena njengothisha wabo uthokoze kanye nabo ekugcineni.

Sifisela wena nomfundi omfundisayo impumelelo ngenkathi usebenzisa lezi zincwadi.

Published by the Department of Basic Education
222 Struben Street
Pretoria
South Africa

© Department of Basic Education

Ninth edition 2019

ISBN 978-1-920458-96-6

This book may not be sold.

The Department of Basic Education has made every effort to trace copyright holders but if any have been inadvertently overlooked the Department will be pleased to make the necessary arrangements at the first opportunity.

IBanga lesi-2

Rainbow WORKBOOKS

Izibalo

NGESIZULU

Le ncwadi ngeka-:



ISIZULU

Incwadi yoku-1

1

Usuku: .....

Mina nomndeni wami

Ngineminyaka eyisishiyagalombili.



Inombolo yendlu yakithi ngu-12.



Yimina omncane kunabo bonke emndenini.



Nginawodadewethu ababili



Ubaba uneminyaka engama-32 ubudala.





Gcwalisa izimpendulo zale mibuzo ephathelene nomndeni wakho.

Igama lami ngingu- _____.

Ngineminyaka e- _____ ubudala.

Eminyakeni emibili edlule nganginеminyaka e- _____ ubudala.

Ngonyaka owodwa ozayo ngizobe ngineminyaka e- _____ ubudala.

Ngihlala e- _____.

Ngubani omdala kunani nonke ekhaya? _____.

Bhala usho ukuthi mdala kangakanani. _____

Ngubani omncane kunani nonke ekhaya? _____

Bhala usho ukuthi mncane kangakanani. _____

Namuhla izinsuku zi- _____ enyangeni.

1 2 3 4 5 6 7 8 9 10



Dweba isithombe somndeni wakho.

1 2 3 4 5 6 7 8 9

Teacher:

Sign:

Date:

11 12 13 14 15 16 17 18 19 20

2

Usuku:

Ukubala



Gcwalisa isikhala.



amehlo

amachashazi

amapheshi



2







amehlo

amachashazi

amapheshi





amehlo

amachashazi

amapheshi



amehlo

amachashazi

amapheshi



Hlukaniselanani amachashazi namapheshi ngokulinganayo.

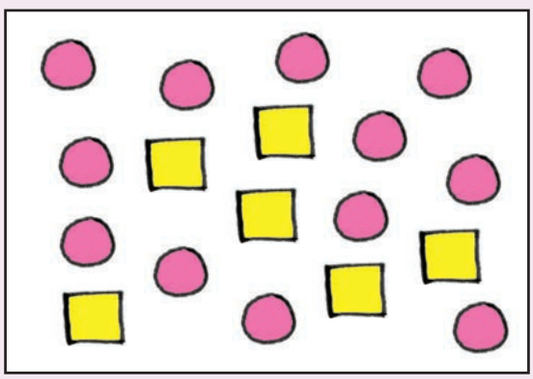





Teacher:

Sign:

Date:

11 12 13 14 15 16 17 18 19 20

3

Usuku:

Izinombolo

1

Funda izinombolo ngezimpawu zazo nangamagama azo.

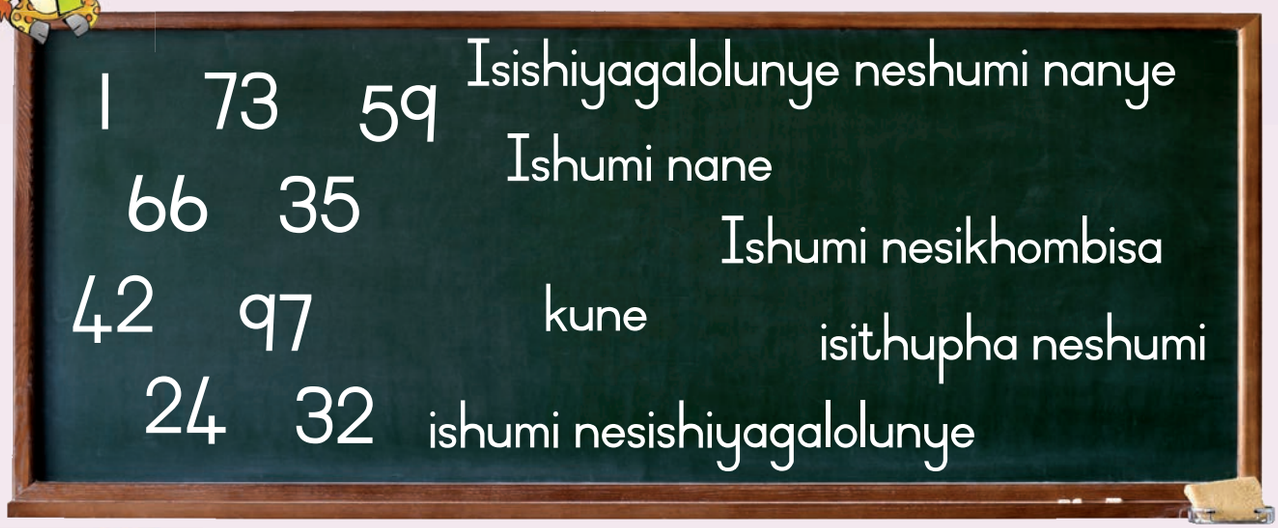

2

Bhala isamba samabhaluni asebhulokhini.

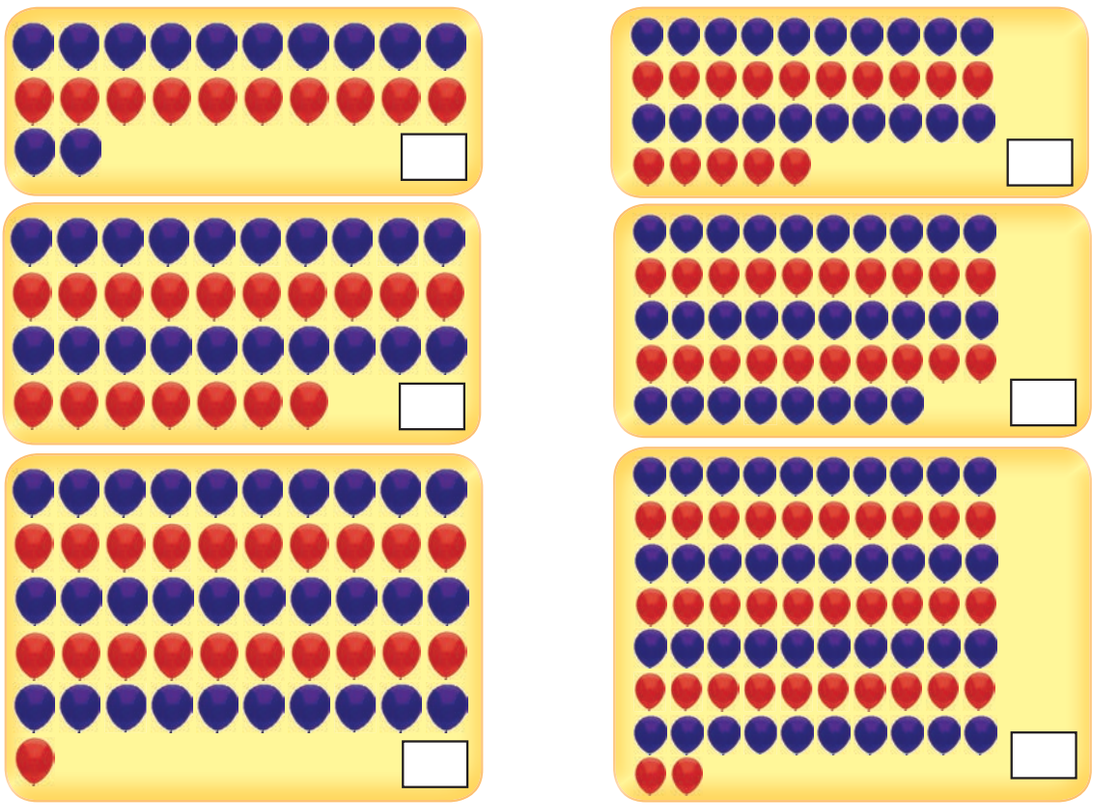





Bhala lezi zinombolo ngamagama.



6 _____ 12 _____

4 _____ 7 _____

8 _____ 17 _____

1 _____ 14 _____

2 _____ 22 _____

5 _____ 18 _____

0 _____ 11 _____

10 _____ 20 _____

3 _____ 15 _____

9 _____ 13 _____



37 38 39 40 41 42 43 44

89 90 91 92 93 94 95 96



Teacher:

Sign:

Date:

11 12 13 14 15 16 17 18 19 20

4

Usuku:

Izinombolo ziyaqhutshwa





Dweba i-△ ezinombolweni ezingelona ugweje, udwebe i-◯ ezinombolweni ezilugweje.



Ezingelona ugweje



Ezilugweje

1	2	3	4	5	6	7	8	9	10
11	12	13	14	15	16	17	18	19	20



Nikeza izindlu izinombolo.







Bala ubuhlalu obumibala mibili.

Bhala inombolo yalokhu:

10 2 = 12

10 3 = ☐

10 5 = ☐

10 8 = ☐

10 9 = ☐

Siyibhala sithi:

10 + 2 = 12

☐ + ☐ = ☐

☐ + ☐ = ☐

☐ + ☐ = ☐

☐ + ☐ = ☐

Ithini impendulo yalokhu?

10 + 1 = ☐	10 + 9 = ☐	10 + 6 = ☐
10 + 8 = ☐	10 + 2 = ☐	10 + 3 = ☐
10 + 5 = ☐	10 + 4 = ☐	10 + 7 = ☐

1 3 5 7 9 11 13 15 17 19

2 4 6 8 10 12 14 16 18 20

Teacher:

Sign:

Date:

11 12 13 14 15 16 17 18 19 20

5

Usuku:

Ukuhlanganisa nokususa





Hlanganisa uphinde ususe.



9 + 8 = 17



18 − 8 = ☐



☐ + ☐ = ☐



☐ + ☐ = ☐



☐ + ☐ = ☐



Bala.

6 + 5 = ☐	8 + 9 = ☐	11 + 3 = ☐	12 − 5 = ☐
8 + 7 = ☐	3 + 8 = ☐	9 − 5 = ☐	16 − 9 = ☐
6 + 4 = ☐	8 + 4 = ☐	8 − 4 = ☐	6 − 4 = ☐





Hlanganisa.

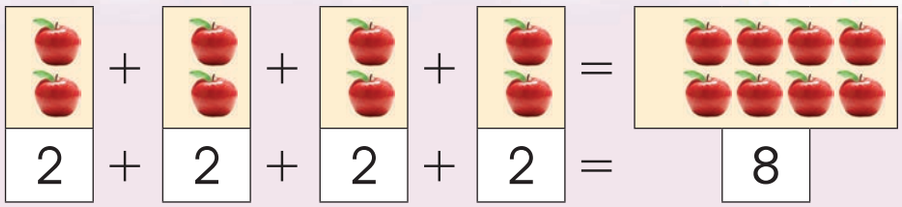

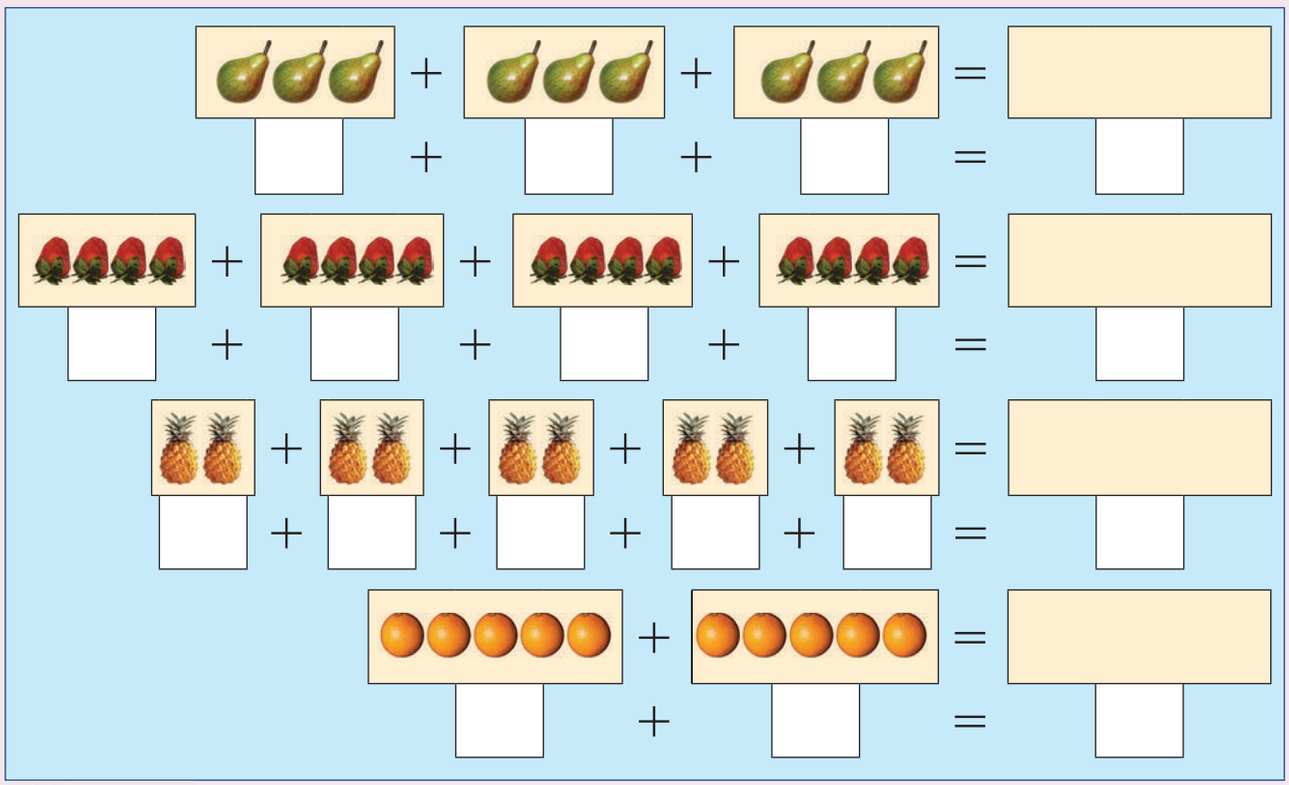



Bala.

2 + 2 + 2 = ☐	1 + 1 + 1 + 1 + 1 + 1 = ☐	2 + 2 + 2 + 2 = ☐
4 + 4 = ☐	3 + 3 + 3 + 3 = ☐	4 + 4 + 4 + 4 = ☐
5 + 5 + 5 = ☐	5 + 5 = ☐	1 + 1 + 1 = ☐



2 + 2 + 2 + 2 + 2 + 2

Teacher:

Sign:

Date:

11 12 13 14 15 16 17 18 19 20

6

Usuku:

Ukwahlukaniselana nemali





Hlukaniselanani izithelo ngokulinganayo.













Qedela.



5c



















Faka umbala ohlwezeni olufanele kanye nasemalini engamaphepha ukuze uma uyihlanganisa yakhe inani elifanayo nelokuqala.



= 10c 10c 5c 2c 1c 2c



= 5c 2c 2c 1c 2c 2c



= R2 R2 R1 R1 R1



= R5 R2 R1 R5 R1 R2



= R2 R2 R5 R5 R2 R1 R5



R1 1c R5 5c R10

Teacher:

Sign:

Date:

11 12 13 14 15 16 17 18 19 20

7

Usuku:

Amaphethini

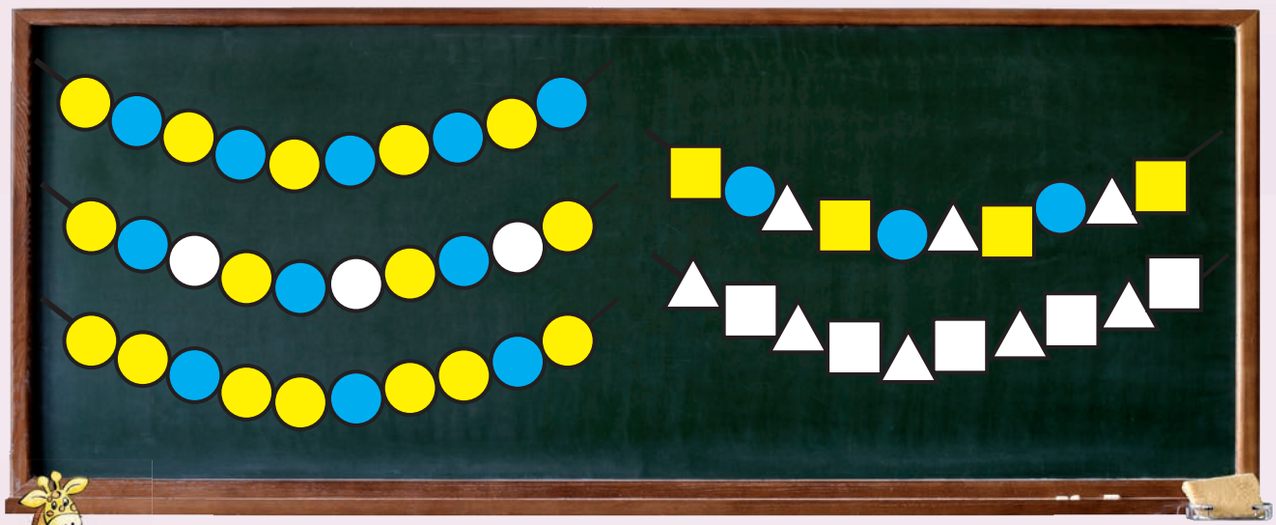

Kopisha amaphethini asebhodini uwabhale ezikhaleni ezingezansi.



Yelula iphethini.

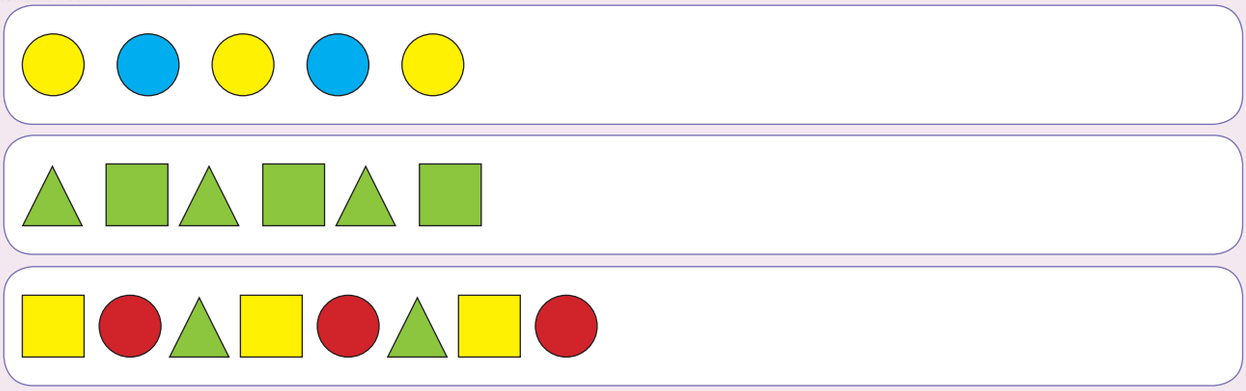

1 2 3 4 5 6 7 8 9 10



Faka umbala ebuhlalwini ngenkathi ubala ngaku-2.



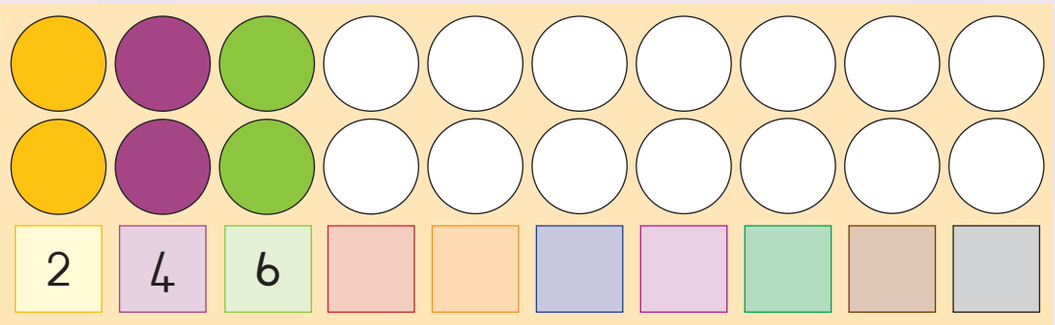



Faka umbala ezimbalini ngenkathi ubala ngaku-5.

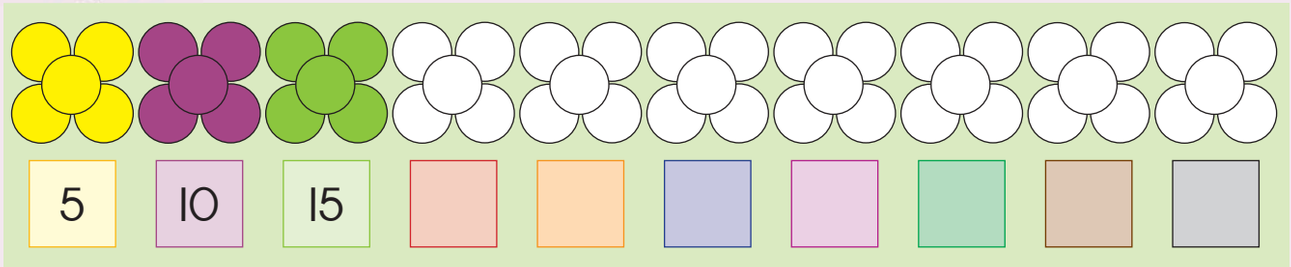



Faka umbala ebuhlalwini ngenkathi ubala nga-10.

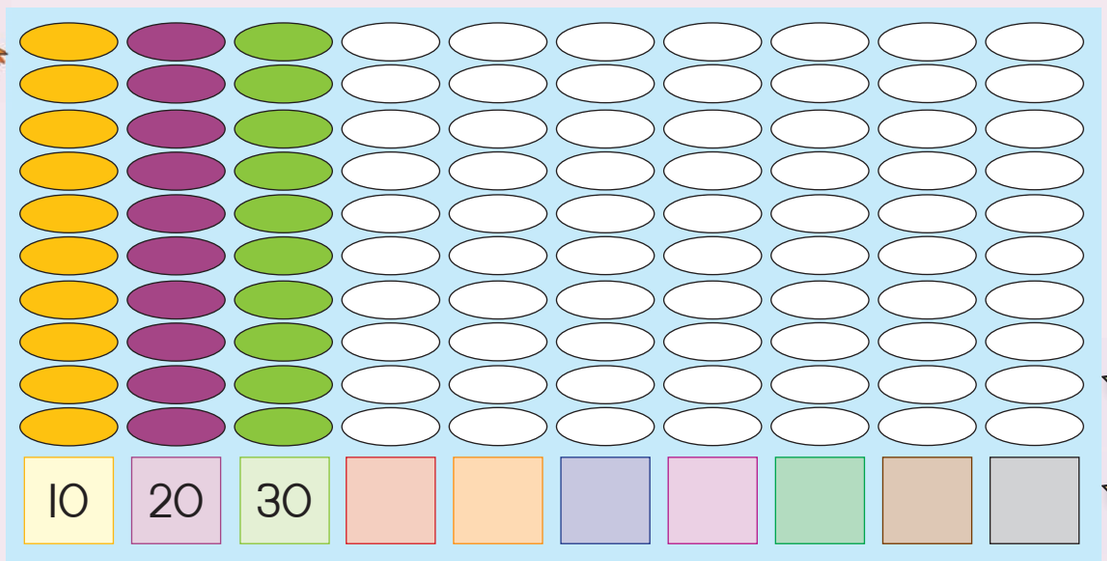



Teacher:

Sign:

Date:

11 12 13 14 15 16 17 18 19 20

8

Usuku:

Izimo



1 Faka umbala osasibhakabhaka konxande, obomvu eziyingini kanye nophuzi konxantathu.

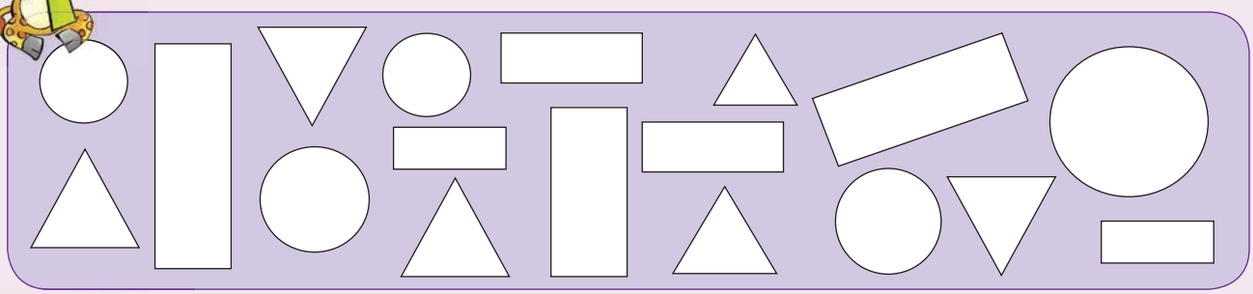

2 Faka umbala obomvu eziyingini, osasibhakabhaka konxande kanye nophuzi konxantathu abancane.

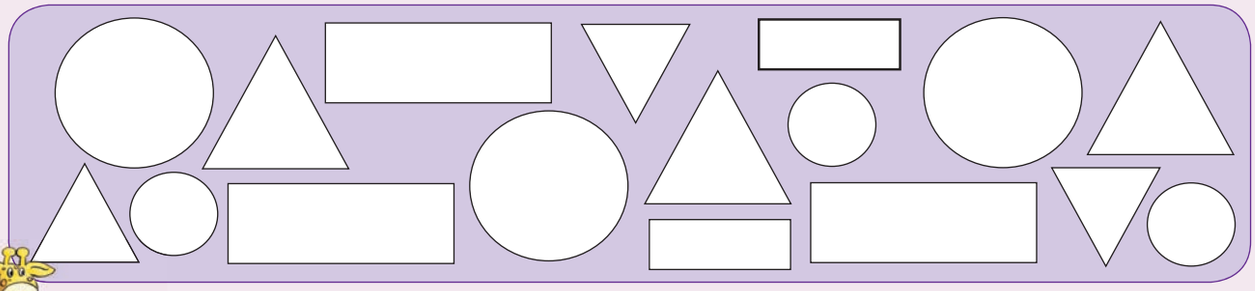

3 Izinhlangothi ziqondile noma ziyiziyingi? Faka umbala empendulweni efanele.



kuqondile | kugobile



kuqondile | kugobile



kuqondile | kugobile





Dweba elinye iphiko lovemvane.





Teacher:

Sign:

Date:

11 12 13 14 15 16 17 18 19 20

9

Usuku:

Amabhola namabhokisi





1 Kokelezela amabhokisi ngokuluhlaza namabhola ngokubomvu.



2 Faka umbala empendulweni efanele.



Ibhokisi | kuyashibilika | kuyagingqika



Ibhola | kuyashibilika | kuyagingqika



Faka umbala empendulweni efanele.



unqenqema olugobile

unqenqema oluqondile



unqenqema olugobile

unqenqema oluqondile



unqenqema olugobile

unqenqema oluqondile



unqenqema olugobile

unqenqema oluqondile



unqenqema olugobile

unqenqema oluqondile



unqenqema olugobile

unqenqema oluqondile



unqenqema olugobile

unqenqema oluqondile



unqenqema olugobile

unqenqema oluqondile

Yisho ukuthi ibhola lingemuva, lingaphambili, liseceleni noma lingaphezulu kwebhokisi.



lingemuva | lingaphambili

liseceleni | liphezulu



lingemuva | lingaphambili

liseceleni | liphezulu



lingemuva | lingaphambili

liseceleni | liphezulu



lingemuva | lingaphambili

liseceleni | liphezulu

ibhola ibhokisi ibhola ibhokisi

Teacher:

Sign:

Date:

11 12 13 14 15 16 17 18 19 20

10

Usuku:

.....

Ubude

Benzani?



1

Yisiphi isitimela esifushane yisiphi eside?





sifushane

side



sifushane

side

2

Yisiphi isakhiwo esiphakeme yisiphi esifushane?

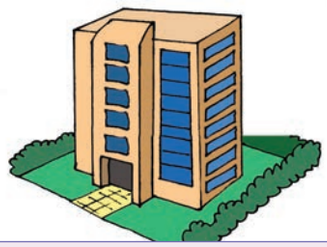

siphakeme

sifushane



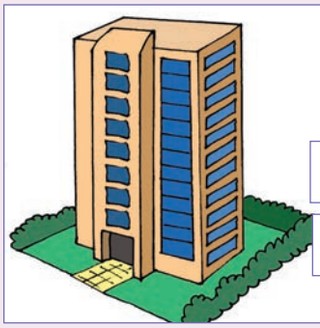

siphakeme

sifushane



Yimuphi umuntu omfushane yimuphi omude?



mfushane	mfushane
mude	mude



Sebenzisa Okusikwayo koku-1 okuyisandla. Lo nxande ngabe mude ngangezandla ezingaki?



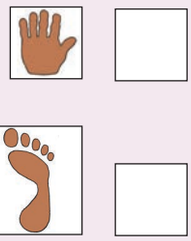



Kala ukuphakama kukanxande usebenzise izandla nezinyawo.

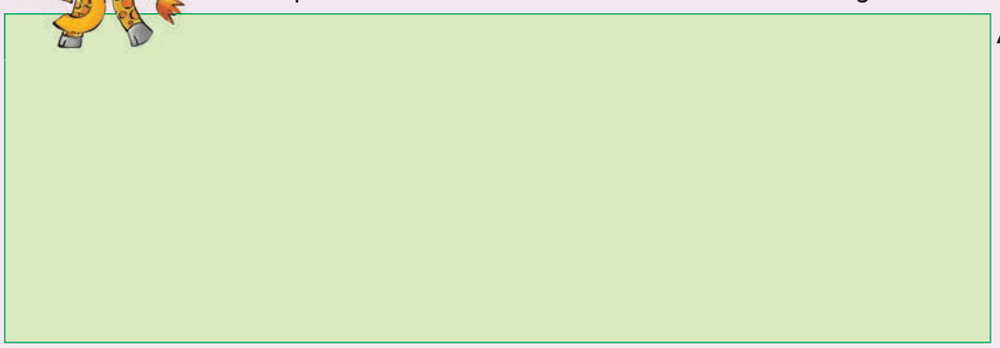

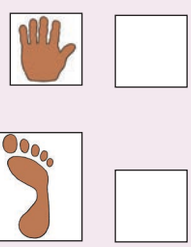





Teacher:
Sign:
Date:

11 12 13 14 15 16 17 18 19 20

11

Usuku:

Isisindo



1

Yisho ukuthi le nto iyasinda noma ilula.



iyasinda | ilula

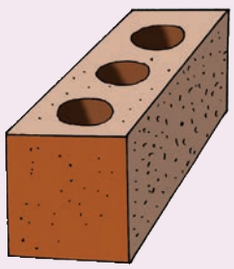

iyasinda | ilula

2

Kokelezela into esindayo.











Le nto ngabe iyasinda noma ilula kunekhilogramu?



iyasinda | ilula



iyasinda | ilula



iyasinda | ilula



iyasinda | ilula



iyasinda ilula

Teacher:
Sign:
Date:

11 12 13 14 15 16 17 18 19 20

12

Usuku:

Umthamo

Xoxa ngalesi sithombe.



Faka umbala empendulweni efanele.



kugcwele	akunalutho	kuwuhhafu



kugcwele	akunalutho	kuwuhhafu



kugcwele	akunalutho	kuwuhhafu



kugcwele	akunalutho	kuwuhhafu



kugcwele	akunalutho	kuwuhhafu



kugcwele	akunalutho	kuwuhhafu

1 2 3 4 5 6 7 8 9 10



Isilinganiso esisodwa singafika egabelweni lokuqala kulo jeke. Zingaki izikali ezingagcwalisa lo jeke?





Zingaki izikali ezithelwe kulo jeke?





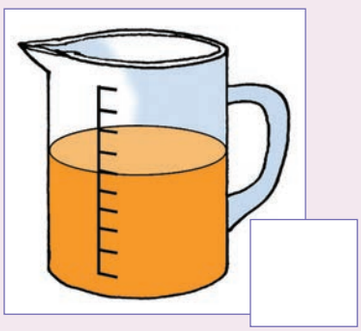



Ujeke okwesokunxele uphethe ilitha eli-1 likajusi. Yimuphi ujeke onojusi ofanayo, yimuphi onojusi omncane kunojeke ongakwesokunxele?





kuyalingana | kuncane



kuyalingana | kuncane



kugcwele akunalutho

Teacher:
Sign:
Date:

13

Usuku:

Isikhathi

Kokusikwayo koku-1, sika amagama uwanamathisele ngaphansi kwezithombe ukukhombisa ukuthi sikhathi sini sosuku.



Qedela umusho.

_____ ekuseni kakhulu.

_____ ekuseni.

_____ ntambama.

_____ nsuku zonke.

_____ zonke izinsuku ntambama.



Izolo | Namuhla | Kusasa









Phendula le mibuzo.

Wenzani umntwana namuhla? _____

Wenzeni umntwana izolo? _____

Uzokwenzani umntwana kusasa? _____



Dweba isithombe sakho.

Izolo	Namuhla	Kusasa



Izolo





Teacher:
Sign:
Date:

11 12 13 14 15 16 17 18 19 20

14

Usuku:

Ikhalenda lezinsuku zokuzalwa



Bhala phezu kwezinyanga.



1 2 3 4 5 6 7 8 9 10



Bhala igama lomfundi ngamunye kwabaseklasini, wabhale kule khalenda yezinsuku zokuzalwa.

uMasingana	uNhlolanja	uNdasa
uMbasa	uNhlaba	uNhlangulana
uNtulikazi	uNcwaba	uMandulo
uMfumfu	uLwezi	uZibandlela

Usuku lwami lokuzalwa lungo—

Teacher:

Sign:

Date:

11 12 13 14 15 16 17 18 19 20

15

Usuku: .....

Qoqa uhlele





Qoqa uphinde uhlele amabhola bese uwadweba ebhokisini elifanele.

amabhola asatshani	amabhola abomvu	amabhola asasibhakabhaka	amabhola aphuzi



Qoqa izimbali uzihlele kahle.

izimbali eziphuzi	izimbali ezibomvu	izimbali ezibukhwebezane	izimbali eziphinki	izimbali ezisawolintshi

1 2 3 4 5 6 7 8 9 10



Hlela lezi zinto. Yenza imidwebo yakho.



izinto ezilula

izinto ezisindayo



amabhola amancane

amabhola amakhulu

amabhokisi amancane

amabhokisi amakhulu



Teacher:

Sign:

Date:

11 12 13 14 15 16 17 18 19 20

Usuku:

Funda uhumushe



Umdwebo wami





Hlela amakhrayoni. Wadwebe.





Hlela izimbali. Zidwebe.





Hlela amafu nothingo lwenkosazana. Kudwebe.







Phendula le mibuzo.

		
onxantathu	onxande	iziyingi

Bangaki onxantathu? _____

Bangaki onxande? _____

Zingaki iziyingi? _____

Ngabe wonxantathu abaningi noma wonxande? _____

Ngabe yiziyingi eziningi noma wonxantathu? _____

Ngabe yiziyingi eziningi noma wonxande? _____

		
akunalutho	kuwuhhafu	kugcwele

Bangaki ojeke abangenalutho? _____

Bangaki ojeke abagcwele? _____

Mangaki amabhodlela agcwele? _____



Teacher:

Sign:

Date:

11 12 13 14 15 16 17 18 19 20

17

Usuku:

Ngaphambili, emva, phakathi

Xoxa ngezinombolo ezisemabhulokhini usebenzise amagama ngaphambili emva phakathi.

1	2	3	4	5	6	7	8	9	10	11	12	13	14	15	16	17	18	19	20	21	22	23	24	25

Isibonelo: Ibhola ngalinye kwabomvu liphakathi kwamabhola asasibhakabhaka.





2

Bhala izinombolo ezifanele ezikweleni.

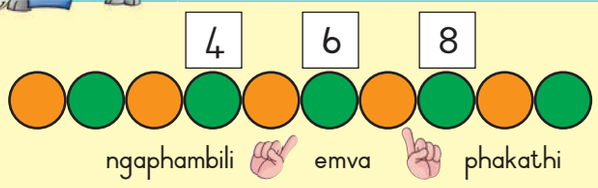

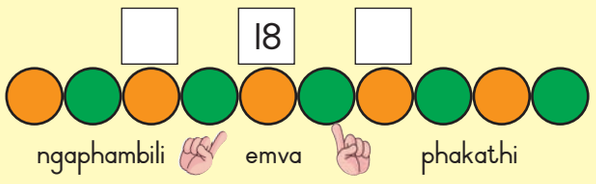

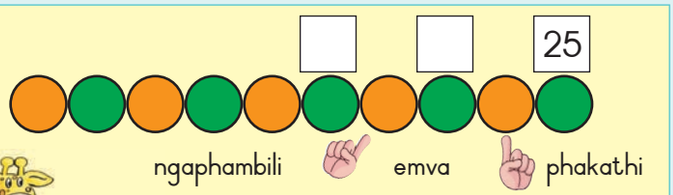

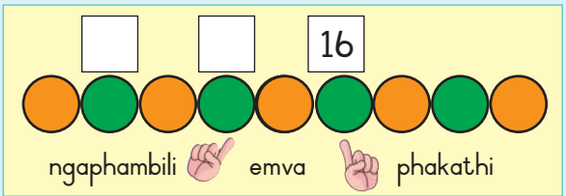

3

Gcwalisa ngezinombolo ezingekho.

	2			5	
	12			15	
13			16		

10			13		
	17			20	
20					25

1 2 3 4 5 6 7 8 9 10 11 12 13 14 15 16 17 18 19 20 21 22 23 24 25

Iyiphi inombolo engaphambi kwe-8? _____

Iyiphi inombolo engemva kwe-16? _____

Iyiphi inombolo ephakathi kwe-8 ne-12? _____





Faka umbala osasibhakabhaka ezinombolweni eziphakathi kwe-14 ne-17. Faka umbala obomvu enombolweni engaphambili kwe-14. Faka umbala ophuzi enombolweni engemva kwe-17.

11	12	13	14	15	16	17	18	19	20

11 12 13 14 15 16 17 18 19 20 21 22 23 24 25 26 27 28 29 30

Bhala izinombolo ezisebuhlalwini obuphuzi.
Sizibiza ngokuthini izinombolo ezisebuhlalwini obuphuzi.

_____

Zibhale zonke izinombolo ezisebuhlalwini obuphinki.
Sizibiza ngokuthini izinombolo ezisebuhlalwini obuphinki?

_____



Hlukanisela izingane ezigqoke okuphuzi ubuhlalu obuphuzi.

Ingane ngayinye ithola ubuhlalu obungaki? _____ . Ngabe bukhona ubuhlalu obusalayo?_____

Hlukanisela izingane ezigqoke okuphinki ubuhlalu obuphinki.

Ingane ngayinye ithola ubuhlalu obungaki? _____ . Ngabe bukhona ubuhlalu obusalayo?_____

Phendula le mibuzo elandelayo.

Bhala izinombolo ezintathu ezingelona ugweje ezingemva kwe-12?_____

Bhala izinombolo ezintathu eziwugweje ezingemva kwe-14?_____

Yiziphi izinombolo eziwugweje eziphakathi kwe-18 nama-24? _____

Bhala izinombolo ezintathu ezingelona ugweje eziphakathi kwe-8 ne-18. _____

Teacher:
Sign:
Date:

18

Usuku:

Izinombolo 1 – 30

Zingaki izincwadi?
Mangaki amabhodlela anopende?



1 Bungaki ubuhlalu?

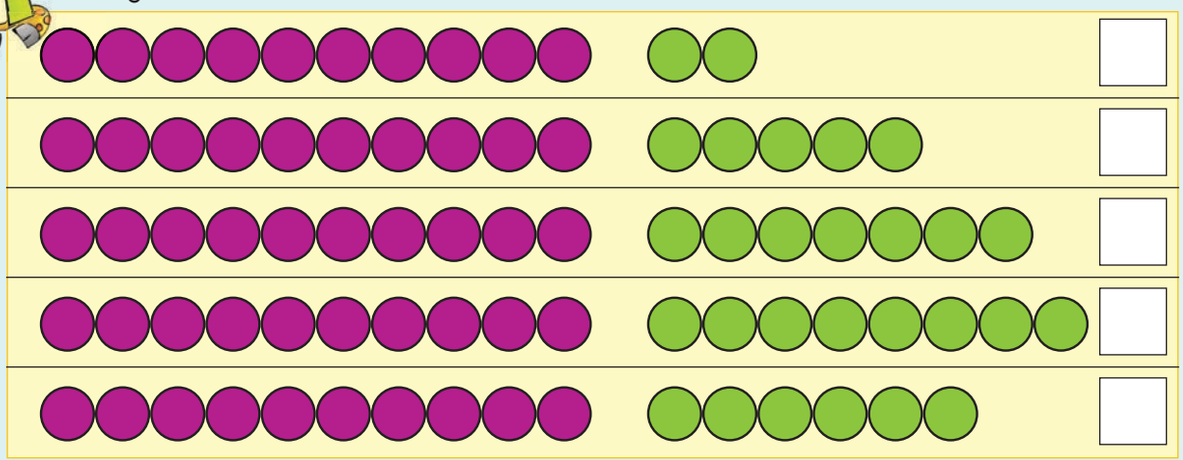

2 Zingaki izincwadi?



3 Gcwalisa ngezinombolo ezingekho.

14	12	15	17	19	13	26	28	21	30
10 4	2	10	7	10					

1 2 3 4 5 6 7 8 9 10



Buka isibonelo sokuqala bese uqedela ezilandelayo.

18	=	ishumi eli-	1	+	imivo eyi-	8	noma	18	=	10	+	8
15	=	ishumi eli-		+	imivo e-		noma		=		+	
19	=	ishumi eli-		+	imivo eyi-		noma		=		+	
22	=	amashumi ama-		+	imivo e-		noma		=		+	
24	=	amashumi ama-		+	imivo e-		noma		=		+	

Bungaki ubuhlalu?

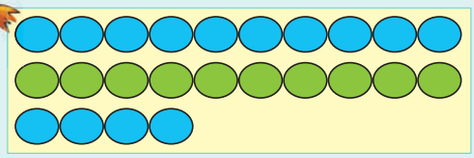

inombolo

Siyibhala sithi:

20 + ☐ = 24

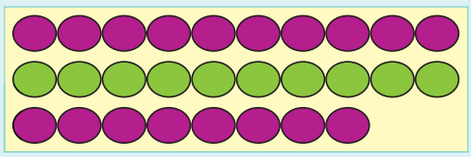

inombolo

Siyibhala sithi:

20 + ☐ = 28

Bhala lokhu ngamagama:

10	_____	11	_____
12	_____	13	_____
14	_____	15	_____
16	_____	17	_____
18	_____	19	_____
20	_____	21	_____
22	_____	23	_____
24	_____	25	_____

Qedela okulandelayo.

25	=	amashumi a-	2	+	imivo e-	5	22	=	amashumi a-	2	+	imivo e-	2
13	=	ishumi eli-		+	imivo e-		21	=	amashumi a-		+	umuvo o-	
26	=	amashumi ama-		+	imivo eyi-		19	=	ishumi eli-		+	imivo eyi-	

Teacher:

Sign:

Date:

19

Usuku:

Imigqa yezinombolo



Gcwalisa ngezinombolo ezingekho.

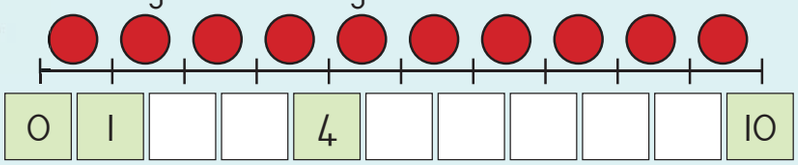

0	1			4						10

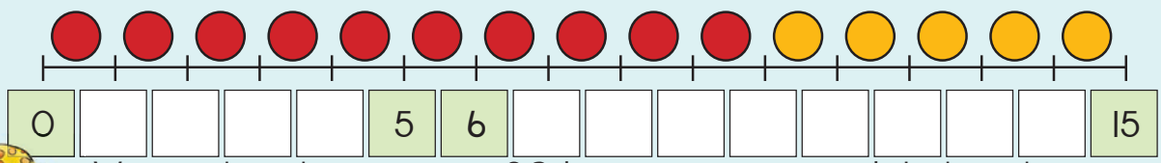

0					5	6									15

Wagxuma kangakanani unogwaja? Sebenzisa umugqa wezinombolo ukuze ukwazi ukuthola izimpendulo.



0	1	2	3	4	5	6	7	8	9	10

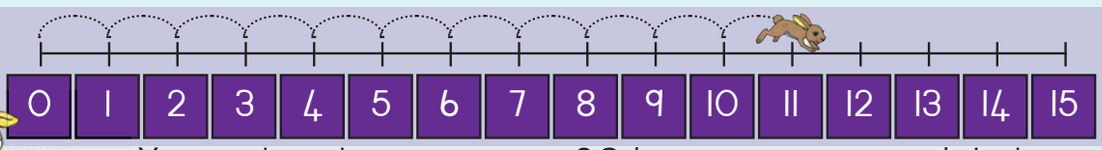

0	1	2	3	4	5	6	7	8	9	10	11	12	13	14	15

Yagxuma kangakanani inyamazane? Sebenzisa umugqa wezinombolo ukuze ukwazi ukuthola izimpendulo.

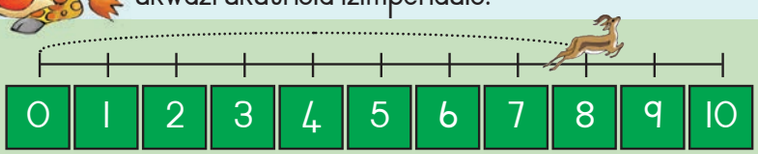

0	1	2	3	4	5	6	7	8	9	10

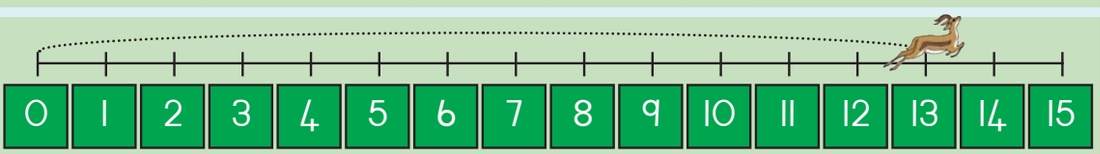

0	1	2	3	4	5	6	7	8	9	10	11	12	13	14	15





Wagxuma kangakanani unogwaja? Sebenzisa umugqa wezinombolo ukuze ukwazi ukuthola izimpendulo.

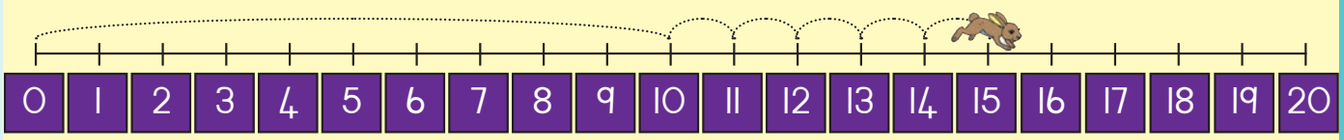

amashumi		imivo		
10	+	5	=	

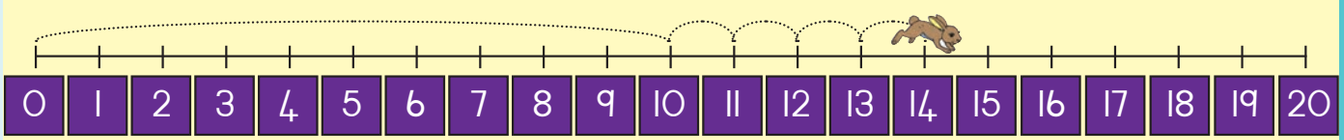

amashumi		imivo		
	+		=	

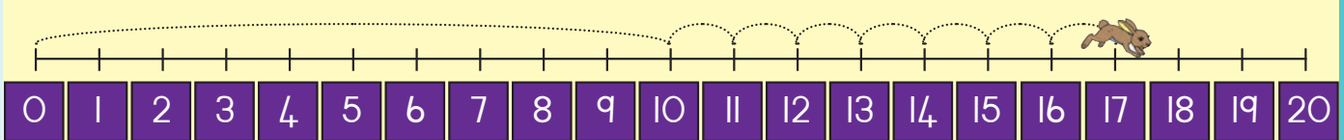

amashumi		imivo		
	+		=	

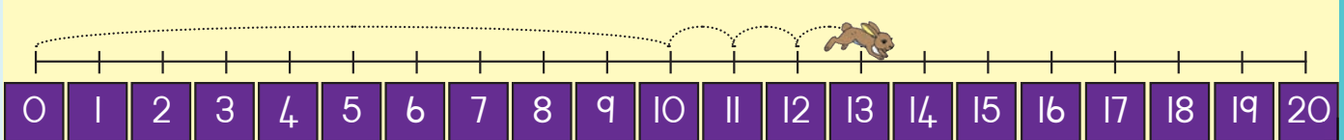

amashumi		imivo		
	+		=	

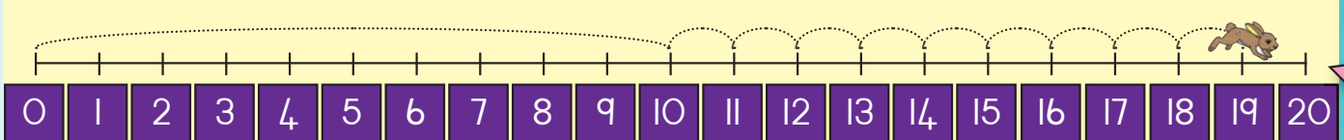

amashumi		imivo		
	+		=	

Teacher:
Sign:
Date:

11 12 13 14 15 16 17 18 19 20

20



Usuku:

Eminye imigqa yezinombolo





Siza unogwaja abhale isibalo. Sebenzisa umugqa wezinombolo ukuze ukwazi ukuthola izimpendulo.

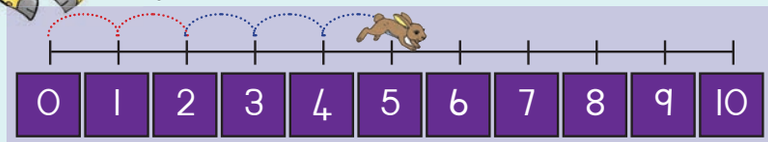

2 + 3 = 5

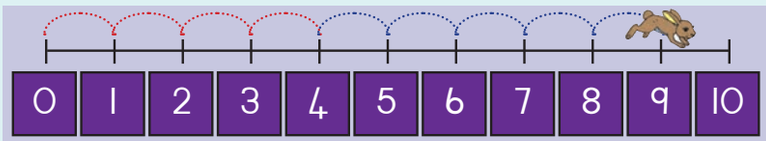

__ + __ = __



Siza inyamazane ibhale isibalo. Sebenzisa umugqa wezinombolo ukuze ukwazi ukuthola izimpendulo.

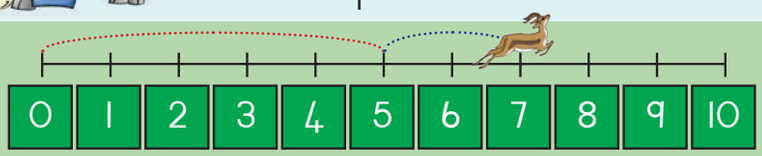

__ + __ = __

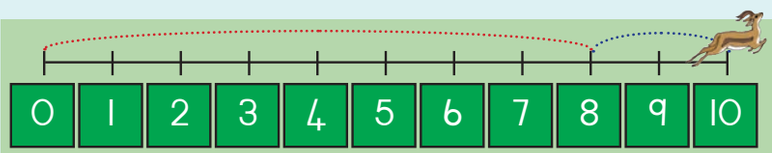

__ + __ = __







Siza unogwaja abhale isibalo.

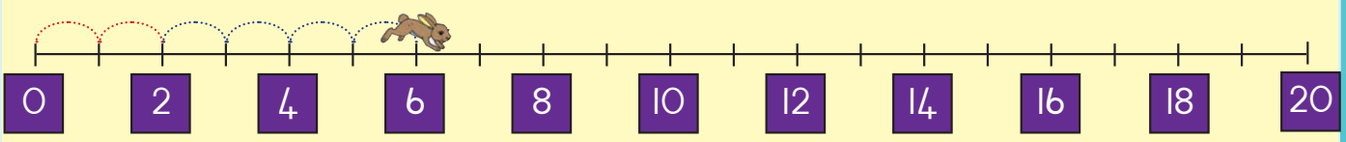

$\square + \square = \square$

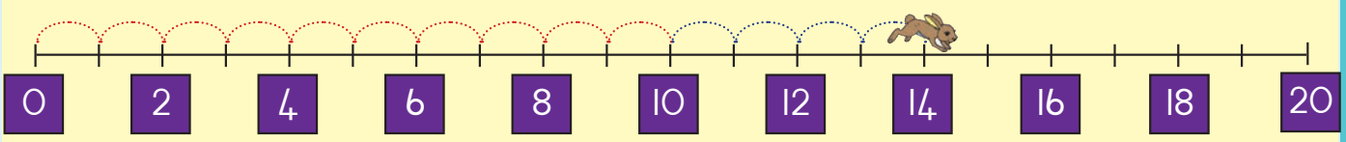

$\square + \square = \square$



Siza inyamazane ibhale isibalo.

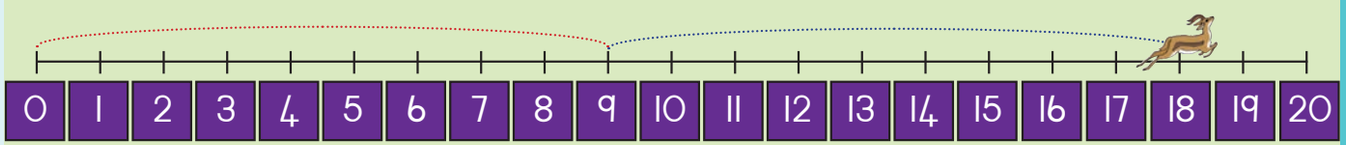

$\square + \square = \square$

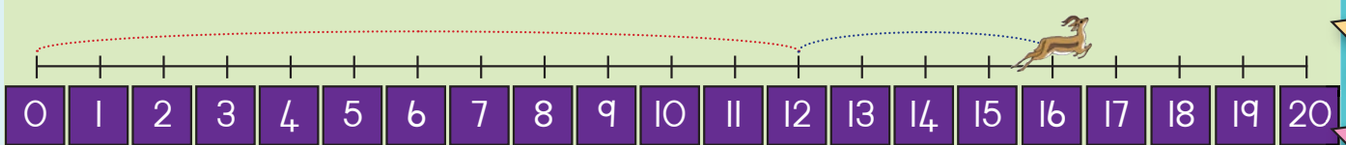

$\square + \square = \square$



Teacher:

Sign:

Date:

11 12 13 14 15 16 17 18 19 20

21

Usuku:

Ukuhlanganisa nokususa

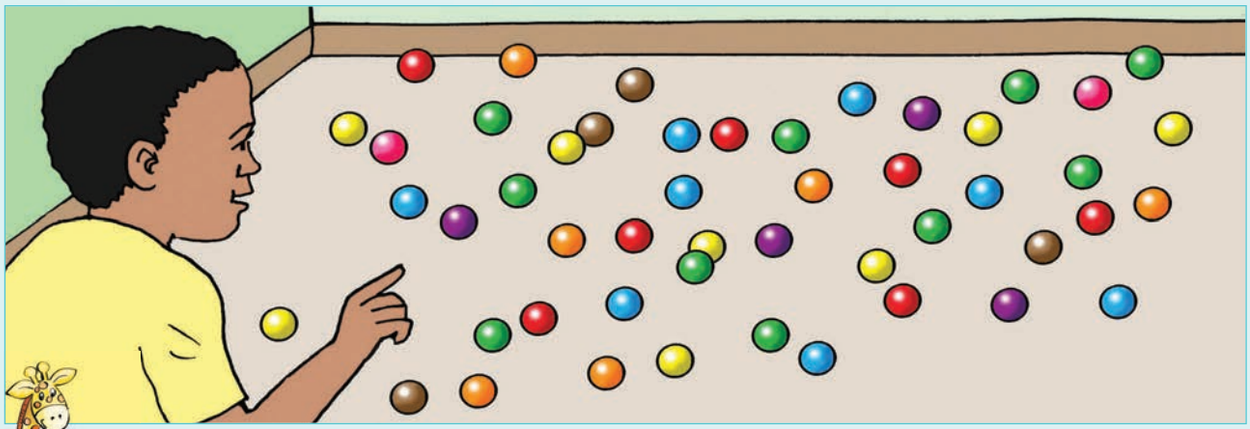



Bhala isamba sobuhlalu.

Bungaki ubuhlalu obubomvu?

Bungaki ubuhlalu obusasibhakabhaka?

Bungaki ubuhlalu obusatshani?

Bungaki ubuhlalu obusawolintshi?

Bungaki ubuhlalu obubukhwebezane?

Bungaki ubuhlalu uma sebuphelele?



Bhala ubuhlalu obunombala ngamunye emabhokisini af anele bese ubuhlanganisa.

bubomvu	+	busatshani	=	
buphuzi	+	buphinki	=	
busawoli-ntshi	+	busasibha-kabhaka	=	
bubukhwe-bezane	+	busatshani	=	
bunsundu	+	buphuzi	=	



Qedela la maphethini.







Hlanganisa ubuhlalu obubomvu nobusasibhakabhaka bese ugcwalisa impendulo ebhokisini.

	+		=	15
8	+	7	=	
	+		+		=	
8	+	2	+	5	=	
	+		=	
9	+	6	=	
	+		+		=	
9	+		+		=	

Qondanisa izithombe nesibalo esifanele bese ugcwalisa ngempendulo efanele.

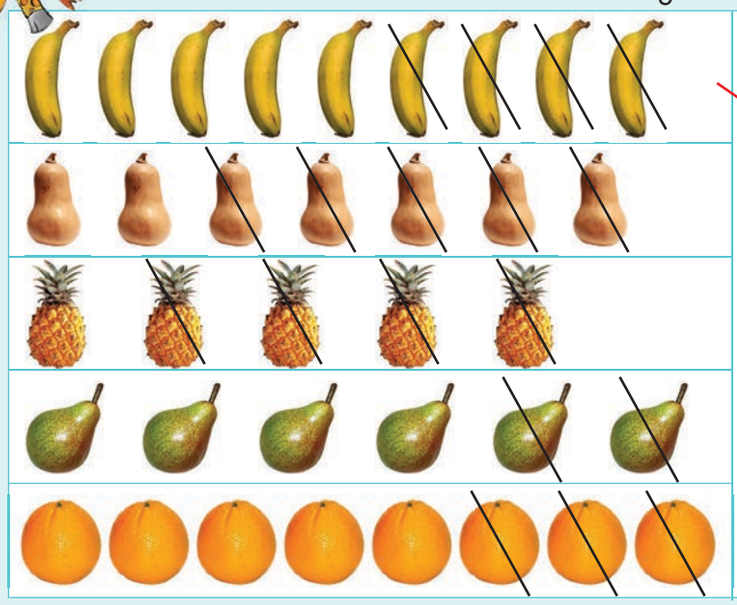

7 – 5 =	
9 – 4 =	
8 – 3 =	
5 – 4 =	
6 – 2 =	

Bhala lesi sibalo:

9 – 6 = 3	– =
– =	– =

Teacher:
Sign:
Date:

11 12 13 14 15 16 17 18 19 20

22

Usuku:

Izinsuku, amasonto, izinyanga

uMsombuluko
uLwesibili
uLwesithathu
uLwesine
uLwesihlanu
uMgqibelo
iSonto

uMasingana	uNhlolanja	uNdasa
uMbasa	uNhlaba	uNhlangulana
uNtulikazi	uNcwaba	uMandulo
uMfumfu	uLwezi	uZibandlela



Phendula imibuzo elandelayo emayelana nezinsuku zesonto.

Yiluphi usuku oluza ngaphambili koLwesithathu? _____

Yiluphi usuku oluza ngemva koLwesithathu? _____

Yiluphi usuku oluza ngemva koMgqibelo? _____

Yiluphi usuku oluphakathi koMsombuluko noLwesithathu? _____

Uma uMsombuluko kuwusuku loku-1, uLwesihlanu wusuku lwe- _____

Yiziphi izinsuku eziphakathi koLwesithathu noMgqibelo?

_____



Phendula le mibuzo elandelayo ngezinyanga.

Iyiphi inyanga engaphambili kukaMbasa? _____

Iyiphi inyanga engemva kwaNhlangulana? _____

Iyiphi inyanga ephakathi kukaNcwaba noMfumfu? _____

Yiziphi izinyanga eziphakathi kukaMasingana nonhlangulana?

_____

Iyiphi inyanga yokuqala onyakeni? _____

Iyiphi inyanga yokugcina onyakeni? _____





Inkolo eNingizimu Afrika



Imigubho yomlandu

Usuku Lwamalungelo Abantu

Usuku Lwenkululeko

Usuku Lwabasebenzi

Usuku Lwentsha

Usuku Lwamakhosikazi

Usuku Lwamasiko

Usuku Lokubuyisana

Usuku lokuzalwa

Usuku lwami lokuzalwa





Okusikwayo kwesi-2: Sebenzisa okokusikwa, unamathisele amaholidi enkolo amathathu kanye nawomphakathi waseNingizimu Afrika ezinyangeni ezisekhalendeni.

uMasingana	uNhlolanja	uNdasa
uMbasa	uNhlaba	uNhlangulana
uNtulikazi	uNcwaba	uMandulo
uMfumfu	uLwezi	uZibandlela



Teacher:

Sign:

Date:

11 12 13 14 15 16 17 18 19 20

23a

Usuku:

Ukuhlanganisa



Buka isithombe bese ubhala inani lezimabule embaleni ngamunye, uzinamathisele emabhokisini afanele, bese uhlanganisa isamba nesamba.

ezibomvu	+	nezisasibhakabhaka	=	3	+	4	=	
ezisatshani	+	nezisasibhakabhaka	=		+		=	
eziphinki	+	nezisasibhakabhaka	=		+		=	
ezisatshani	+	nezisawolintshi	=		+		=	
ezibomvu	+	nezisatshani	=		+		=	
ezisawolintshi	+	nezisasibhakabhaka	=		+		=	

Hlanganisa.

3 + 2 =	4 + 6 =	9 + 3 =
6 + 5 =	7 + 8 =	8 + 4 =
9 + 5 =	8 + 6 =	7 + 4 =
9 + 9 =	7 + 5 =	8 + 8 =
7 + 6 =	9 + 6 =	7 + 7 =





3 Bhala lesi sibalo:

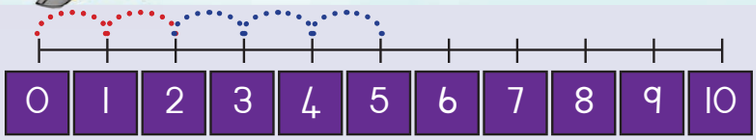

2 + 3 = 5

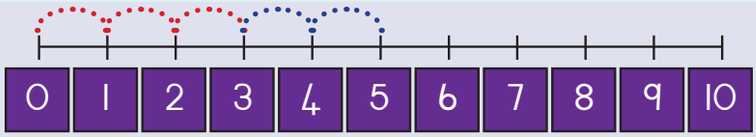

__ + __ = __

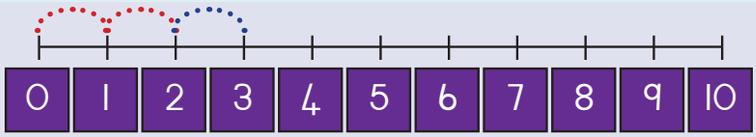

__ + __ = __



__ + __ = __

4 Linganisa izikali. Sesikwenzele okokuqala.

5 = 1 + 4

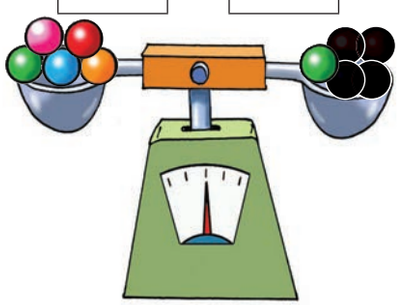

6 = 2 + __



3 + __ = __



2 + 1 = 1 + __

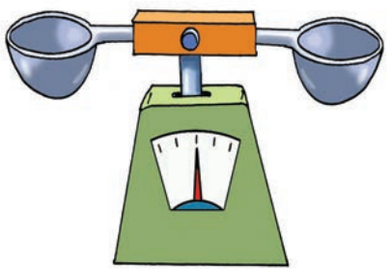

6 + 3 = 3 + __

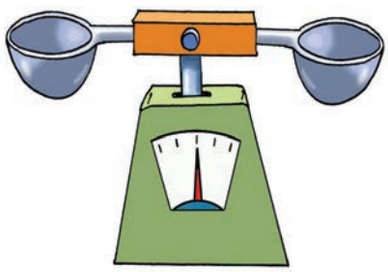

2 + __ = 8 + 2

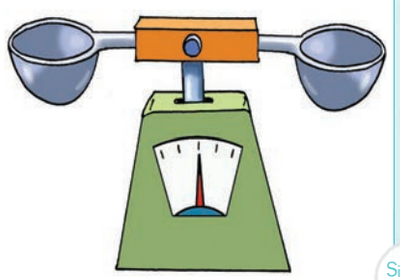

Teacher:

Sign:

Date:

11 12 13 14 15 16 17 18 19 20

23b



Usuku:

Ukususa

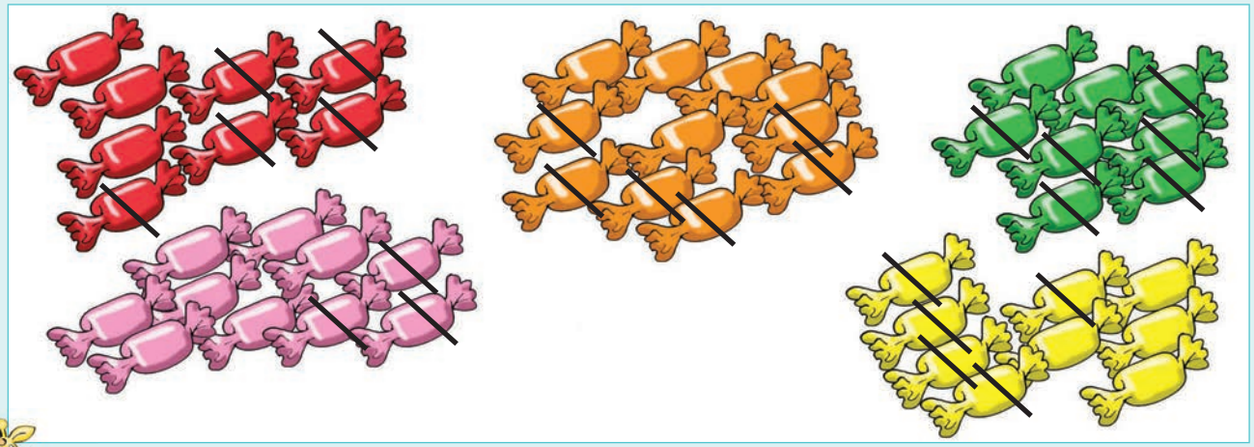



Buka lesi sithombe bese ubhala isibalo sokususa.

Amaswidi abomvu	=	8	−	5	=	3
Amaswidi asatshani	=		−		=	
Amaswidi aphuzi	=		−		=	
Amaswidi asawolintshi	=		−		=	
Amaswidi aphinki	=		−		=	



Susa.

5 − 3 =	10 − 6 =	12 − 3 =
11 − 5 =	15 − 7 =	12 − 4 =
14 − 9 =	14 − 8 =	11 − 4 =
18 − 9 =	12 − 5 =	16 − 8 =
13 − 7 =	15 − 6 =	14 − 7 =





Qedela.

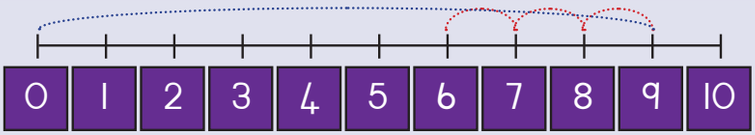

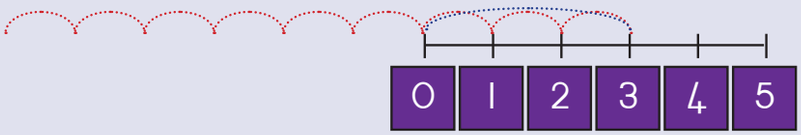

9 – 3

Akulingani na-

3 – 9

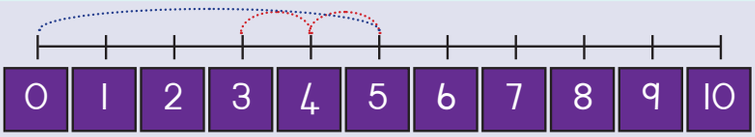

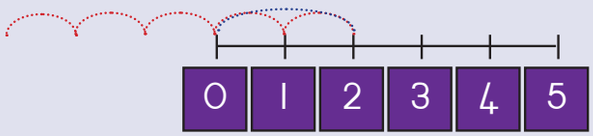

5 – 2

Akulingani na-

2 – 5



Bhala lesi sibalo:

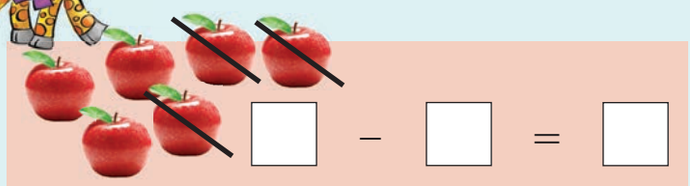

□ – □ = □

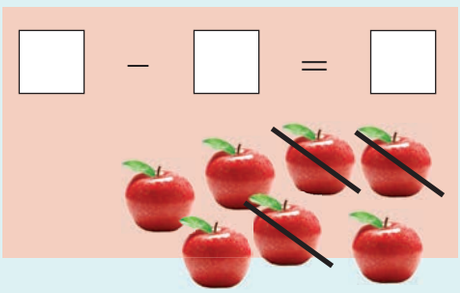

□ – □ = □



□ – □ = □



□ – □ = □



□ – □ = □



Teacher:

Sign:

Date:

11 12 13 14 15 16 17 18 19 20

24



Usuku:

Kuyaqhutshekwa nokuhlanganisa

1

Qondanisa amakhadi nezibalo ezifanele.

2	8	7	5	3
10	10	10	10	10

2

Sebenzisa umugqa wezinombolo. Bhala isibalo sokuhlanganisa. Sikwenzele okokuqala.

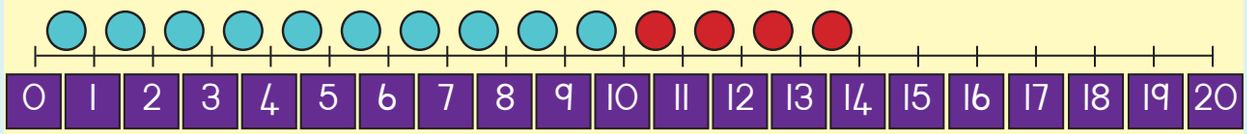

10 + 4 = 14

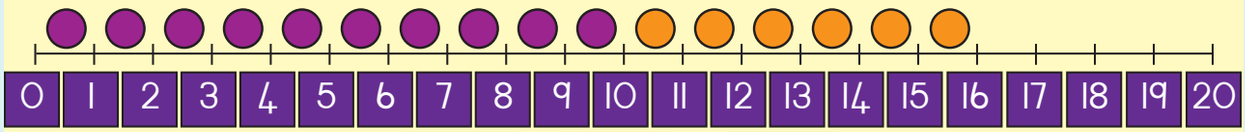

__ + __ = __

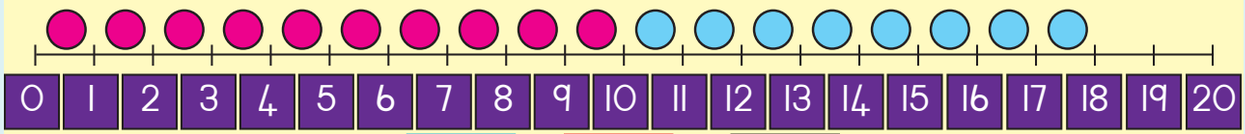

__ + __ = __

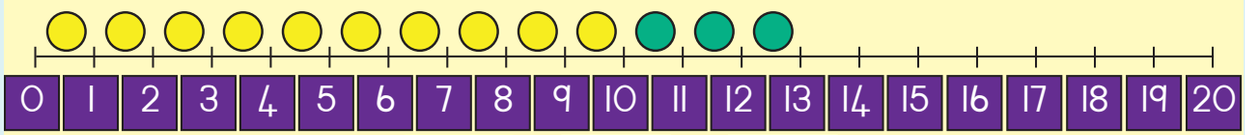

__ + __ = __







Hlanganisa.

10	+	3	=	13	10	+	2	=	
10	+	5	=		10	+	7	=	
10	+	1	=		10	+	6	=	
10	+	4	=		10	+	8	=	
10	+	9	=		10	+	3	=	



Hlanganisa.

16 + 13

10		10		20	16	+	13	=	29
6	+	3	=	9					

14 + 12

10		10							
4	+	2	=			+		=	

17 + 11

10		10							
7	+	1	=			+		=	

15 + 13

10		10							
5	+	3	=			+		=	

16 + 12

10		10							
6	+	2	=			+		=	

18 + 12

10		10							
8	+	2	=			+		=	



ULisa unezibali eziyi-9 kanti u-Aakar uneziyi- 8.

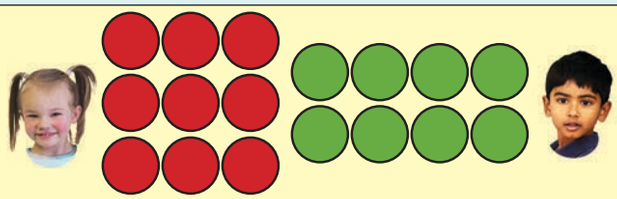

Sithini isamba?

Teacher:

Sign:

Date:

Usuku:

.....

Imali

Yini esebhange lami eliyingulubana?



Sika imali eyizinhlamvu kokubekelwe ukusikwa okunguNombolo 3 unamathisele amanani afanele lapha.

	
	
	



3 Mangaki amasenti?













4 Izibalo zamagama.

USuzi unama-50c. Umama wakhe umphe ama-20c. Unamalini seyiyonke uSuzy?

_____

Nginama-90c. Ngithenge iswidi elibiza ama-30c. Ngisele namalini?

_____

Teacher:
Sign:
Date:

11 12 13 14 15 16 17 18 19 20

Usuku:

Imali yamaphepha

Malini enginayo esikhwameni semali?

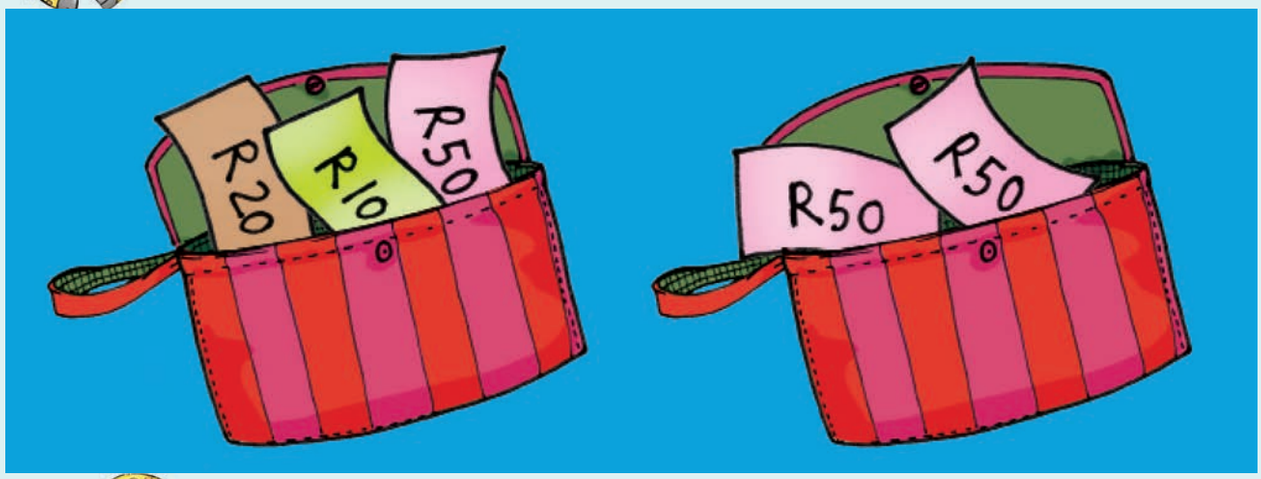

Sika imali yamaphepha Kokusikwayo kwesi-3 unamathisele amanani ayo lapha.

R 30	R 70
R 40	R 60
R 110	R 80



3 Mangaki amarandi?













4 Izibalo zamagama.

Ngonge ama-R50. Ngithole ama-R20 ngosuku lwami lokuzalwa. Nginamalini manje?

_____

Nginama-R90. Ngithenge incwadi ebiza ama-R30. Ngisele namalini?

_____

Teacher:
Sign:
Date:

11 12 13 14 15 16 17 18 19 20

27



Usuku:

.....

Amaphethini



Shaya izandla ngephethini.

Shaya izandla	Shaya izandla Shaya izandla	Shaya izandla	Shaya izandla Shaya izandla	Shaya izandla	Shaya izandla Shaya izandla	Shaya izandla	Shaya izandla Shaya izandla	Shaya izandla	Shaya izandla Shaya izandla	Shaya izandla
Shaya izandla	Shaya izandla Shaya izandla	Shaya izandla Shaya izandla Shaya izandla	Shaya izandla	Shaya izandla Shaya izandla	Shaya izandla Shaya izandla Shaya izandla	Shaya izandla	Shaya izandla Shaya izandla	Shaya izandla Shaya izandla Shaya izandla	Shaya izandla	Shaya izandla Shaya izandla



Okusikwayo kwesi-4.

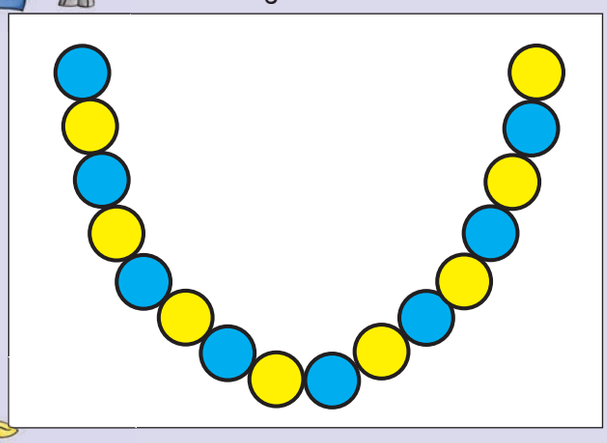



Yenza isithombe sakho ngezinsalela zobuhlalu. Sebenzisa Okusikwayo kwesi-4.



Kopisha la maphethini alandelayo.

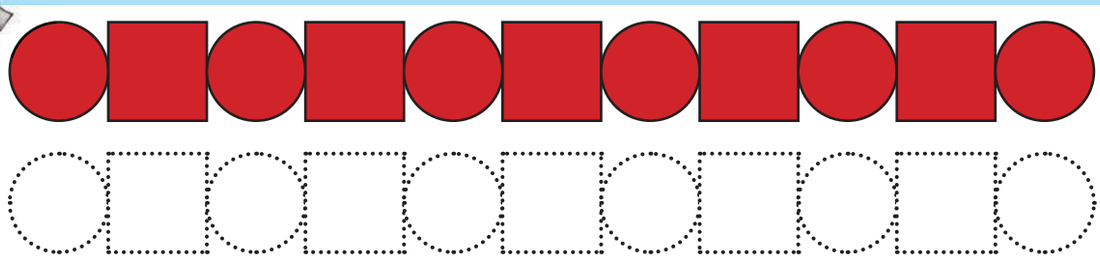



Kopisha la maphethini.





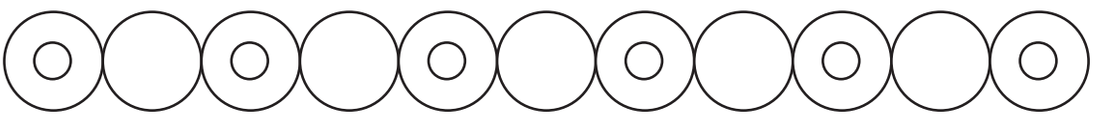

Teacher:

Sign:

Date:

11 12 13 14 15 16 17 18 19 20



Usuku:

Amaphethini ayaqhutshwa



Chaza iphethini ngalinye. La magama alandelayo azokusiza.



unxande | isikwele | unxantathu | isiyingi | imibala



Faka umbala ephethinini elilandela leli elilandelayo.





Dweba iphethini elilandelayo.

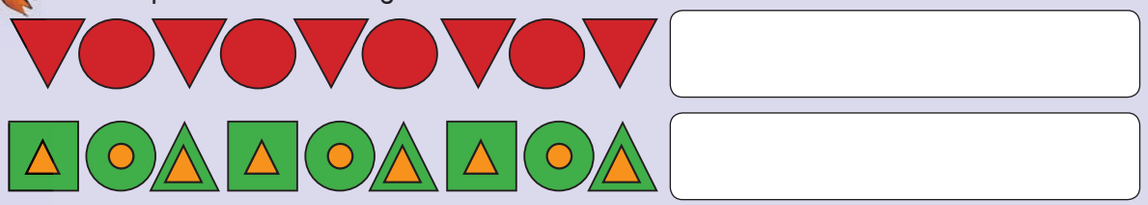



Nweba leli phethini.

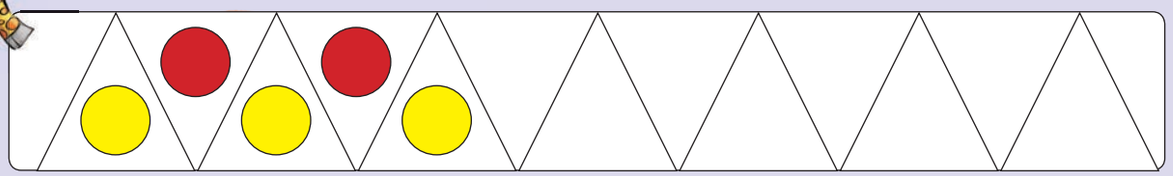





Dweba iphethini lakho usebenzise:



Dweba iphethini elilandelayo.

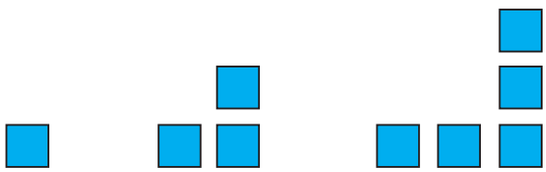

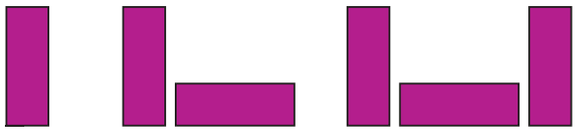

Qedela lokhu okulandelayo ukuze ugcine sewunesiyingi phezulu.

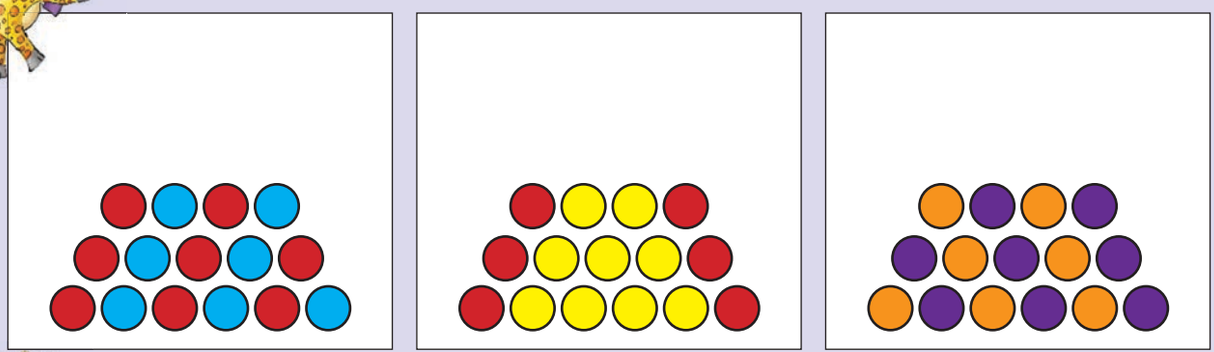

Yenza amaphethini akho usebenzise izimo ezingezansi.

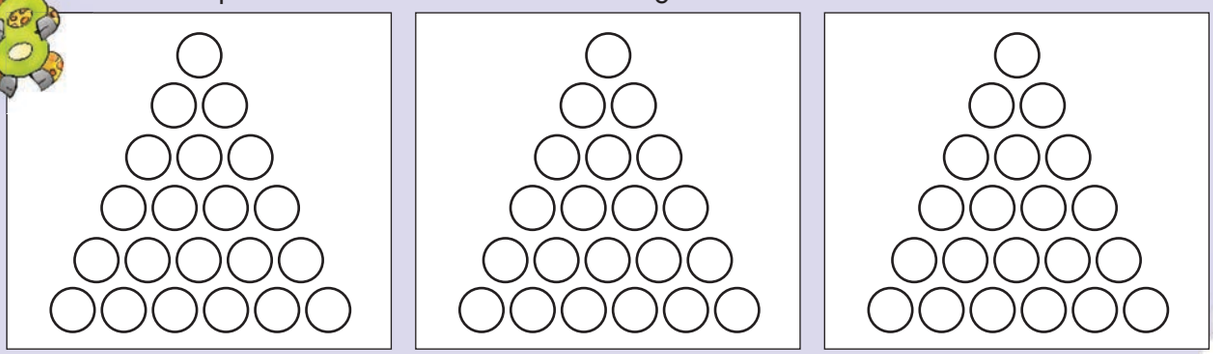

Teacher:

Sign:

Date:

11 12 13 14 15 16 17 18 19 20



Usuku:

Ukuphindaphinda: × 2

1 Mangaki amaswidi etafuleni ngalinye?



Uwabale kanjani amaswidi?
(Abanye abantwana bangathi 1, 2, 3... Abanye bathi 2, 4, 6...)

2 Qedela lokhu okulandelayo. Sesikwenzele okokuqala.



amaqoqo a-4 anezinto ezi-2	2 + 2 + 2 + 2 = 8	4 × 2 = 8
amaqoqo a-5 anezinto ezi-2	2 + 2 + 2 + 2 + 2 =	5 × 2 =
amaqoqo ayi-6 anezinto ezi-2	2 + 2 + 2 + 2 + 2 + 2 =	6 × 2 =
amaqoqo ayi-7 anezinto ezi-2	2 + 2 + 2 + 2 + 2 + 2 + 2 =	7 × 2 =
amaqoqo ayi-8 anezinto ezi-2	2 + 2 + 2 + 2 + 2 + 2 + 2 + 2 =	8 × 2 =

3 Yenza umdwebo walokhu okulandelayo.

amaqoqo a-3 anezinto ezi-2	amaqoqo a-4 anezinto ezi-2	amaqoqo ayi-9 anezinto ezi-2





Yenza umdwebo ngalokhu okulandelayo.

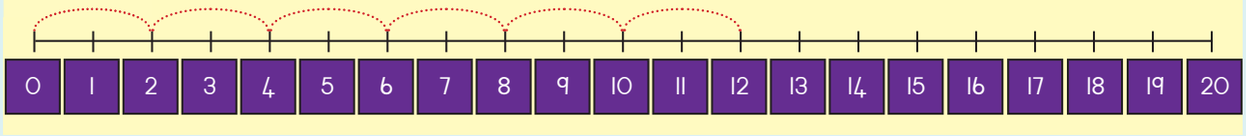

2, 4, 6, 8, ___ , ___

$2 + 2 + 2 + 2 + 2 + 2 =$ ☐

amaqoqo ayi-6 anezinto ezi-2 = ☐

$6 \times 2 =$ ☐

Umdwebo



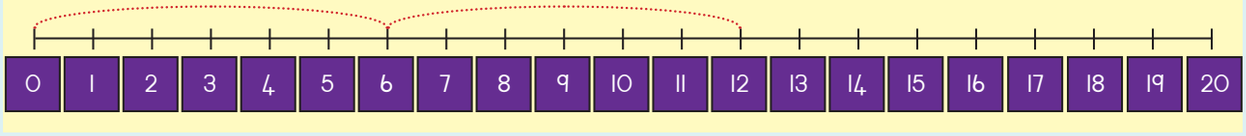

6, ___

$6 +$ ☐ $=$ ☐

amaqoqo a-2 anezinto ezi- ☐ = ☐

$2 \times$ ☐ $=$ ☐

Umdwebo

Isicabucabu sinamehlo ama-2. Zinamehlo amangaki izicabucabu eziyi-7?

☐

2 4 6 8 10 12 14

16 18 20 22 24 26

Teacher:

Sign:

Date:

11 12 13 14 15 16 17 18 19 20

30

Usuku:

Ukuphindaphinda: × 5

Mangaki amaswidi etafuleni ngalinye?



Qedela lokhu okulandelayo. Sesikwenzele okokuqala.

amaqoqo a-3 anezinto ezi-5	5 + 5 + 5 = 15	3 × 5 = 15
amaqoqo a-2 anezinto ezi-5	5 + 5 =	2 × 5 =
amaqoqo ayi-4 anezinto ezi-5	5 + 5 + 5 + 5 =	4 × 5 =
amaqoqo ayi-6 anezinto ezi-5	5 + 5 + 5 + 5 + 5 + 5 =	6 × 5 =
amaqoqo a-7 anezinto ezi-5	5 + 5 + 5 + 5 + 5 + 5 + 5 =	7 × 5 =

Yenza umdwebo ngalokhu okulandelayo.

amaqoqo a-3 anezinto ezi-5	amaqoqo a-4 anezinto ezi-5	amaqoqo a-5 anezinto ezi-5







Yenza umdwebo ngalokhu okulandelayo.

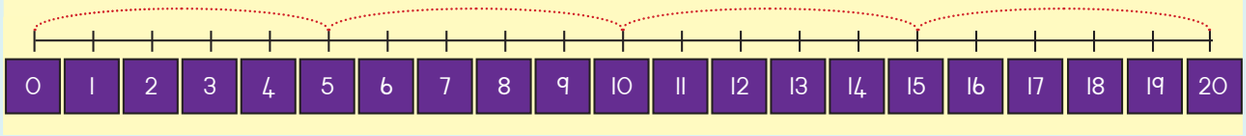

5, 10, 15, ___

5 + 5 + 5 + 5 = ☐

amaqoqo a-4 anezinto ezi-5 = ☐

4 × 5 = ☐

Umdwebo

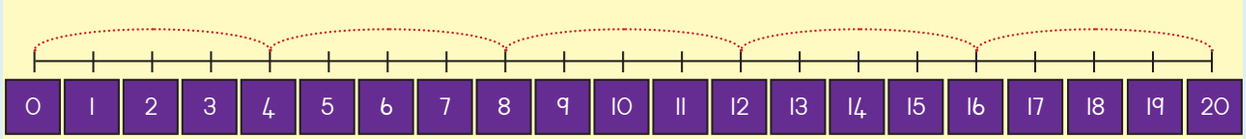

4, 8, 12, ___, ___

4 + 4 + 4 + 4 + 4 = ☐

amaqoqo a-5 anezinto ezi-4 = ☐

5 × 4 = ☐

Umdwebo



5 10 15 20 25 30

35 40 45 50



Teacher:

Sign:

Date:

31

Usuku:

Izindaba zokuphindaphinda

Yenza indaba yakho usebenzisa isamba sezindebe, izindlebe, amehlo, izandla nezinyawo.



Singabangani abayi-10. Sinezandla ezingaki sezizonke?

Yenza umdwebo.

Wukhombise ezibalini.

Wukhombise emgqeni wezinombolo.

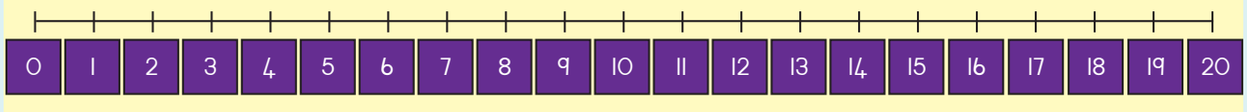

____ + ____ = ____

____ × ____ = ____

1 2 3 4 5 6 7 8 9 10



Umndeni kaSusana unamapheya ayi-10 ezicathulo. Zingaki izicathulo sezizonke?

Yenza umdwebo.

Wukhombise ezibalini.

Wukhombise emgqeni wezinombolo.

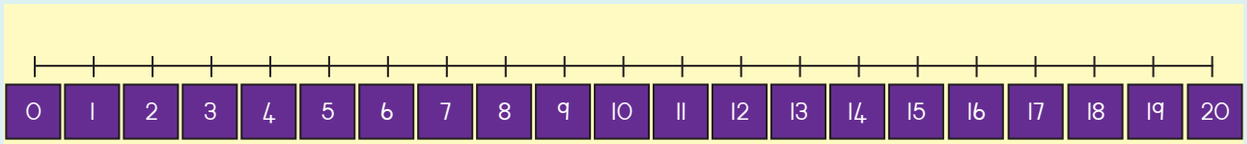



____ + ____ = ____ ____ × ____ = ____

Bhala indaba yakho ngabantwana abayi-6 nezandla zabo.



5 10 15 20 25 30 35

Teacher:
Sign:
Date:

11 12 13 14 15 16 17 18 19 20

Usuku:

.....

Izinto ezingonhlangothi-ntathu



Faka umbala obomvu kuwo wonke amabhola, oluhlaza emabhokisini kanye noluhlaza okotshani kumasilinda.

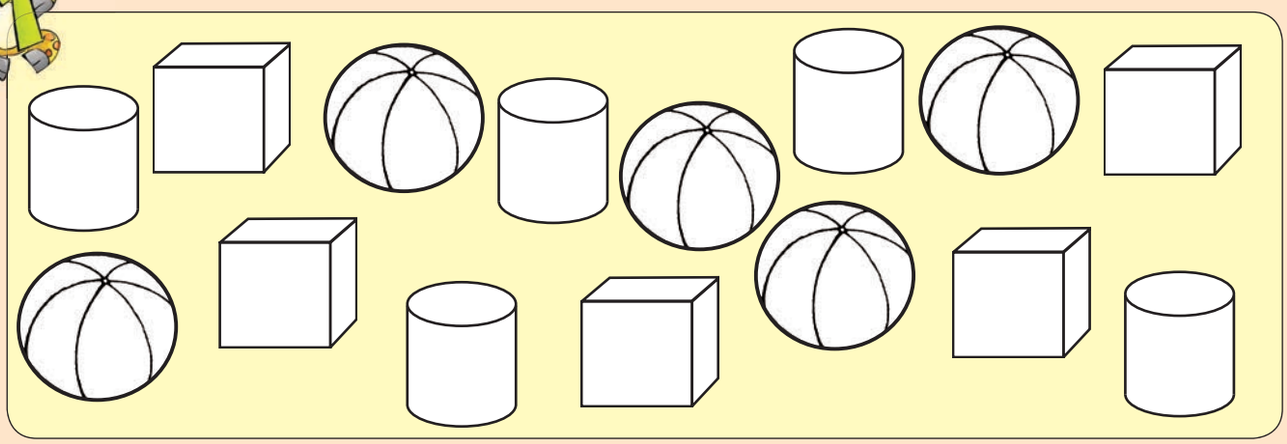

2 Khetha impendulo efanele.

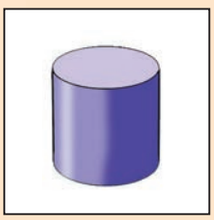

izinqenqema eziqondile

izinqenqema ezigobile

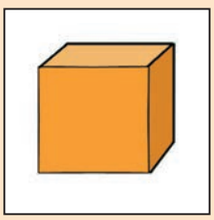

izinqenqema eziqondile

izinqenqema ezigobile



izinqenqema eziqondile

izinqenqema ezigobile



3 Yisho ukuthi le nto izogingqika yini noma izoshibilika.



izoshibilika / izogingqika

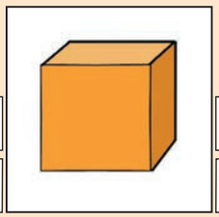

izoshibilika / izogingqika

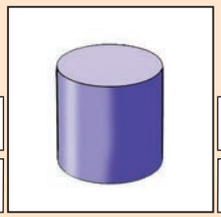

izoshibilika / izogingqika

4 Kulezi zinto zingaki ozibona esithombeni: amasilinda, amabhokisi namabhola?

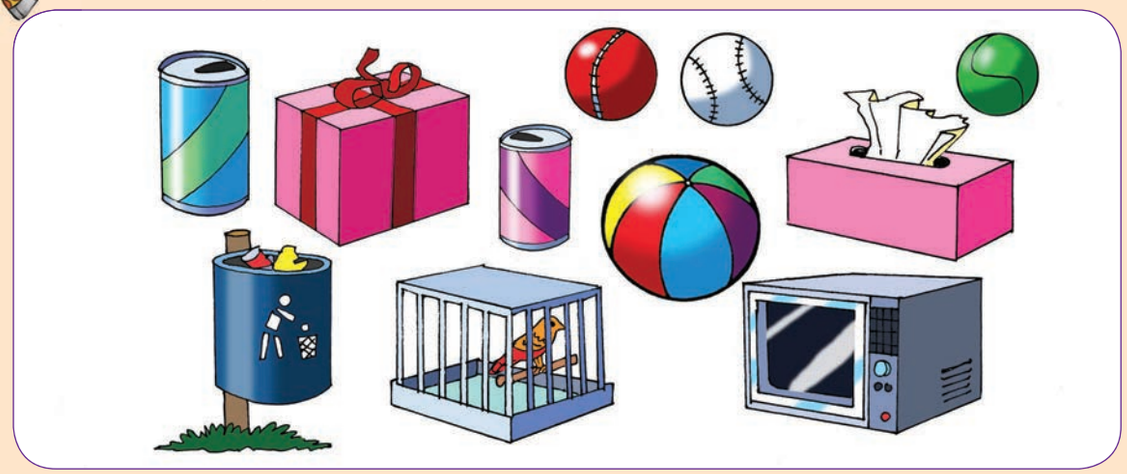

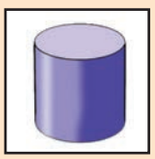

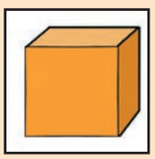



5 Likuphi ibhola? Kungabe lingaphambili kwebhokisi? Kungabe liseceleni? Kungabe lingemuva? Kungabe lingaphezulu?

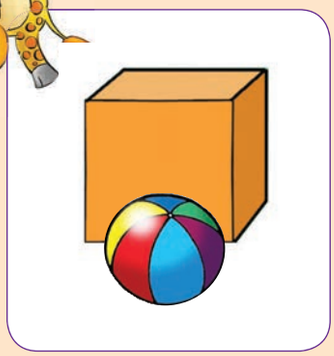

lingaphambili _____
liseceleni _____ lingemuva

_____ lingaphezulu _____

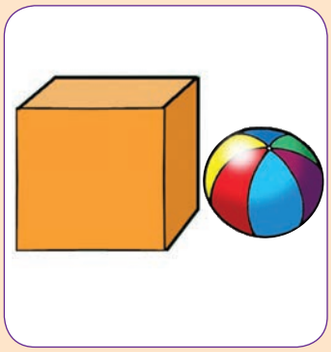

lingaphambili _____
liseceleni _____ lingemuva

_____ lingaphezulu _____

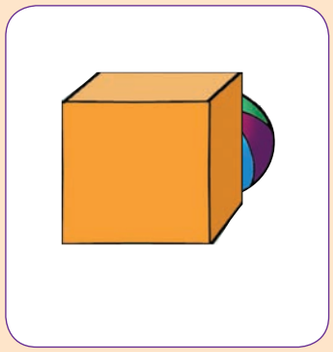

lingaphambili _____
liseceleni _____ lingemuva

_____ lingaphezulu _____

Teacher:
Sign:
Date:

11 12 13 14 15 16 17 18 19 20

33

Usuku:

Landelanisa uphinde uqhathanise izinombolo: 1 – 40

Ngubani onamawolintshi amaningi?



Ngubani onama-aphula amaningi?



Gcwalisa amabhokisi angenalutho ezintweni zokubala ubuhlalu.

1	2	3	4	5		7			10
	12				16		18		
21				25	26				30
31					36				40

Buka lobu buhlalu bese uphendula imibuzo.

Iyiphi inombolo encane kune-8? ☐

Iyiphi inombolo enkulu kune-13? ☐

Iyiphi inombolo encane kunama-20? ☐

Iyiphi inombolo encane kunama-24? ☐





Faka umbala osasibhakabhaka ezinombolweni ezincane kune-10 nobomvu kwezinkulu kune-10.

1	2	3	4	5	6	7	8	9	10
11	12	13	14	15	16	17	18	19	20

Faka umbala osatshani ezinombolweni ezincane kunama-30 kodwa ezinkulu kunama-24.

20	21	22	23	24	25	26	27	28	29	30

Faka umbala ophuzi ezinombolweni ezincane kunama-40 kodwa ezinkulu kunama-36.

30	31	32	33	34	35	36	37	38	39	40

Faka umbala osatshani ezinombolweni ezingelona ugweje nophuzi kweziwugweje.

1	2	3	4	5	6	7	8	9	10
11	12	13	14	15	16	17	18	19	20
21	22	23	24	25	26	27	28	29	30
31	32	33	34	35	36	37	38	39	40
41	42	43	44	45	46	47	48	49	50

Iyiphi inombolo ewugweje engemva kwe-10?

Iyiphi inombolo engelona ugweje engaphambili kwe-10?

Bhala phansi izinombolo ezingelona ugweje eziphakathi kwe-14 nama-24.

Bhala phansi izinombolo eziwugweje eziphakathi koku-5 nokuyi-15.

Iyiphi inombolo ewugweje engemva kwama-21?

Iyiphi inombolo engelona ugweje engaphambili kwama-24?

Bhala phansi izinombolo ezingelona ugweje eziphakathi kwama-20 nama-30.

Bhala phansi izinombolo eziwugweje eziphakathi kwama-20 nama-30.

Teacher:
Sign:
Date:

11 12 13 14 15 16 17 18 19 20

34

Usuku:

Landelanisa uphinde uqhathanise izinombolo: 40 – 50

1 Ngubani onophayinaphu omningi kunabanye?  Noma 







2 Bala ubuhlalu bese ugcwalisa amabhokisi angenalutho.

1	2	3	4	5					
								19	
							28		

	32								
									50
51	52	53	54	55	56	57	58	59	60

3 Buka lobu buhlalu bese uphendula imibuzo.

Iyiphi inombolo encane kunoku-3? ☐

Iyiphi inombolo enkulu kunama-31? ☐

Iyiphi inombolo encane kunama-38? ☐

Iyiphi inombolo encane kunama-47? ☐





Faka umbala osatshani ezinombolweni ezincane kunama-40 kodwa ezinkulu kunama-36.

30	31	32	33	34	35	36	37	38	39	40

Izinombolo ezincane kunama-40.

Izinombolo ezinkulu kunama-36.

Faka umbala osatshani ezinombolweni ezingelona ugweje nophuzi ezinombolweni eziwugweje.

40	41	42	43	44	45	46	47	48	49	50

Iyiphi inombolo ewugweje engemva kwama-40?

Iyiphi inombolo engelona ugweje engaphambili kwama-43?

Bhala phansi izinombolo ezingelona ugweje eziphakathi kwama-40 nama

Bhala phansi izinombolo eziwugweje eziphakathi kwama-40 nama-50.

Iyiphi inombolo engelona ugweje engemva kwama-40?

Iyiphi inombolo engelona ugweje engaphambili kwama-41?

Teacher:

Sign:

Date:

11 12 13 14 15 16 17 18 19 20

35

Usuku:

Izinombolo 40 – 50

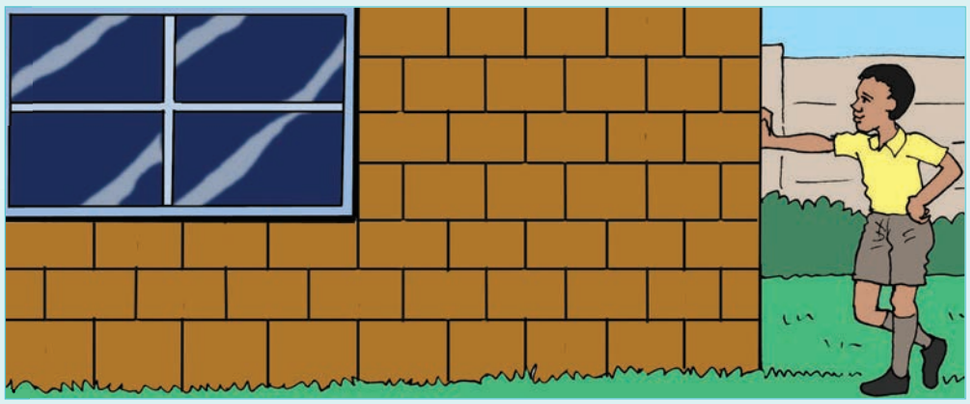

Bungaki ubuhlalu?

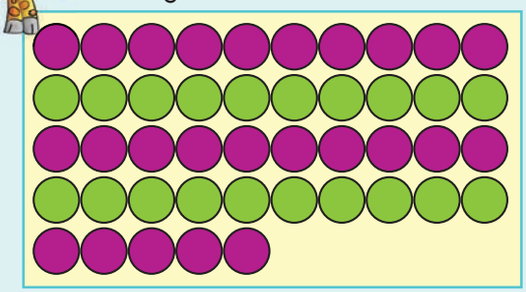

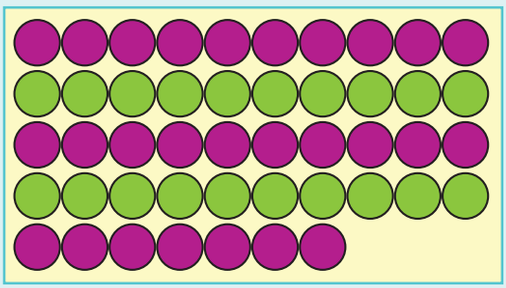

Inombolo	Siyibhala sithi:	Inombolo	Siyibhala sithi:
45	40 + 5 = 45		+ =

Qedela lokhu okulandelayo.

20	21	22							
30				34					
		42							

Qedela lokhu okulandelayo.

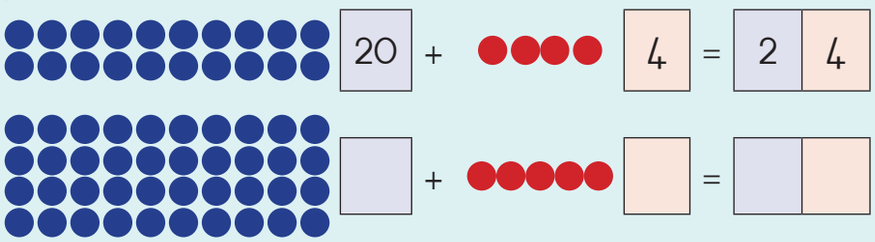



Bhala lokhu ngamagama:

41 _____ 42 _____

43 _____ 44 _____

45 _____ 46 _____

47 _____ 48 _____

49 _____ 50 _____

Buka isibonelo sokuqala bese uqedela okulandelayo.

45	=	4	amashumi +	5	imivo		
43	=		amashumi +		imivo		
42	=		amashumi +		imivo		

44	=		amashumi +		imivo		
41	=		amashumi +		imivo		
48	=		amashumi +		imivo		

Bhala le nombolo kukholamu efanele.

	Amashumi	Imivo
27		
34		
46		
41		
39		

Teacher:
Sign:
Date:

11 12 13 14 15 16 17 18 19 20



Usuku:

.....

Izikwele, onxande, onxantathu neziyingi



Ugogo wenze ingubo enhle yokwemboza umbhede. Thola lezi zimo kuyo.

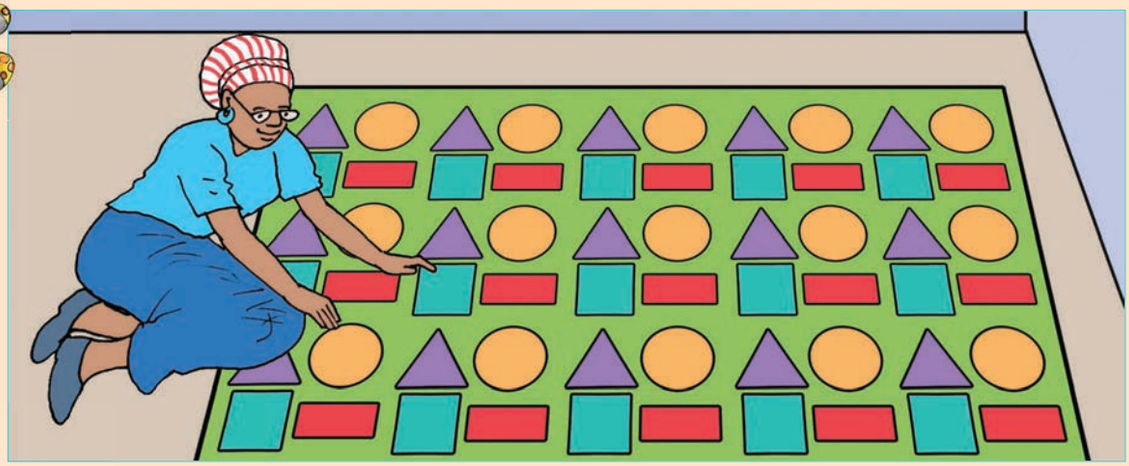



Faka umbala osasibhakabhaka ezikweleni, ophuzi konxande, osatshani konxantathu nobomvu eziyingini.





Khetha impendulo efanele.



izinqenqema eziqondile

izinqenqema ezigobile



izinqenqema eziqondile

izinqenqema ezigobile



izinqenqema eziqondile

izinqenqema ezigobile



izinqenqema eziqondile

izinqenqema ezigobile



Kungaki futhi ubale wathola okungaki?



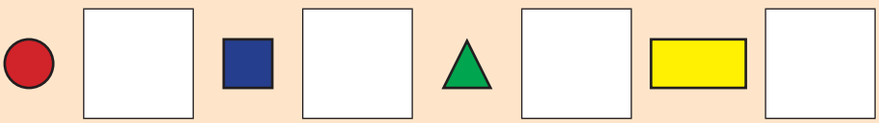

Dweba isithombe sakho usebenzise iziyingi, izikwele, onxantathu nawonxande.

Teacher:
Sign:
Date:

11 12 13 14 15 16 17 18 19 20

37

Usuku:

Izimpawu eziningi zezibalo 1 – 20

1 Ukukhumbula masinya.

4 + 5 – 1 =	13 – 9 + 2 =	20 – 7 + 1 =	10 + 5 – 4 =
10 + 3 + 2 =	9 + 3 – 2 =	8 – 2 – 1 =	13 – 8 + 1 =
9 – 4 – 3 =	18 – 9 – 4 =	7 + 8 + 1 =	16 – 7 + 3 =
14 – 6 + 4 =	12 – 5 – 2 =	19 – 10 + 5 =	6 + 5 – 3 =

2 Hlanganisa lokhu okulandelayo.

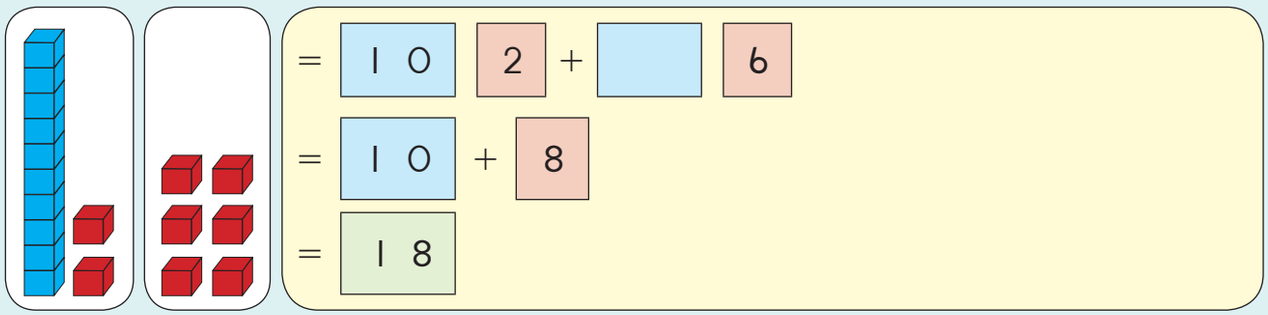

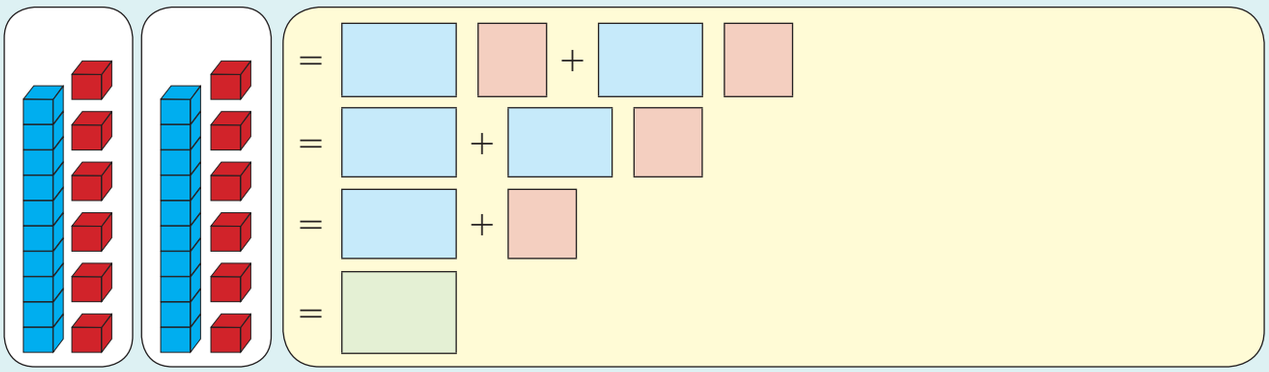

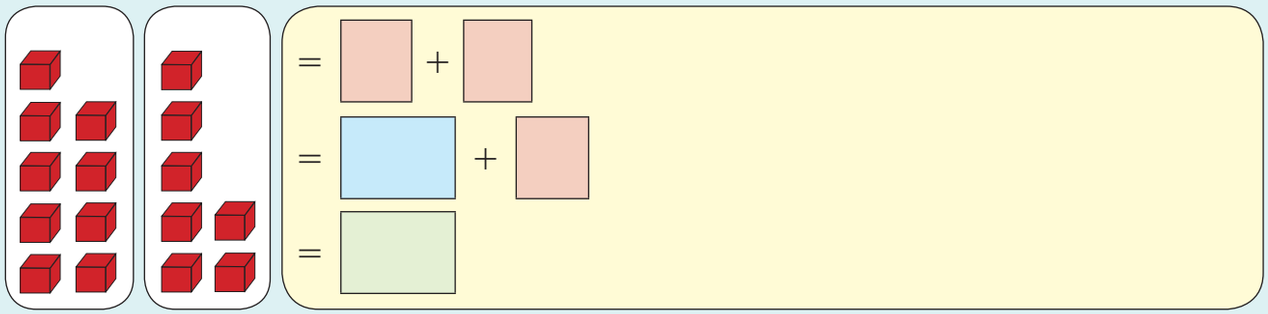





3 Susa lokhu okulandelayo.

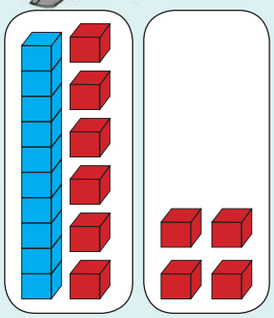

= 10 6 − 4

= 10 − 2

= 8

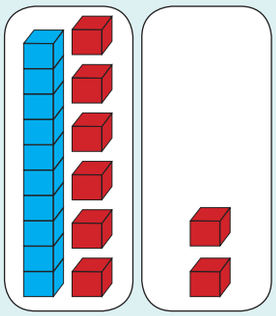

= ☐ ☐ − ☐ ☐

= ☐ + ☐

= ☐

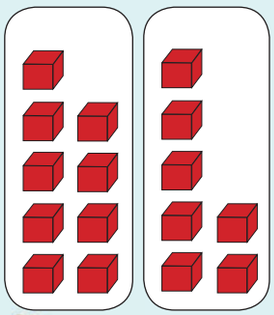

= ☐ − ☐

= ☐



4 Ngithenge amaswidi ayi-15. Ngidle ama-2. Ngiphe umngani wami a-4. Mangaki amaswidi engisele nawo?



Teacher:

Sign:

Date:

11 12 13 14 15 16 17 18 19 20

38

Usuku:

Izimpawu eziningi zezibalo 20 – 50

1 Ukukhumbula masinya.

20 + 2 – 1 =	36 – 6 + 2 =	42 – 2 + 4 =	47 + 4 – 1 =
30 + 3 + 6 =	42 + 9 – 1 =	33 – 2 – 1 =	49 – 1 + 2 =
55 – 5 – 0 =	38 – 7 – 1 =	45 + 1 + 2 =	50 – 5 + 3 =
24 – 3 + 2 =	32 – 5 – 2 =	49 – 10 + 1 =	29 + 5 – 4 =

2 Hlanganisa lokhu okulandelayo.

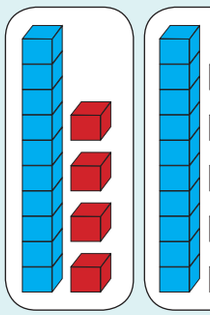

= □ □ + □ □

= □ □ + □

= □

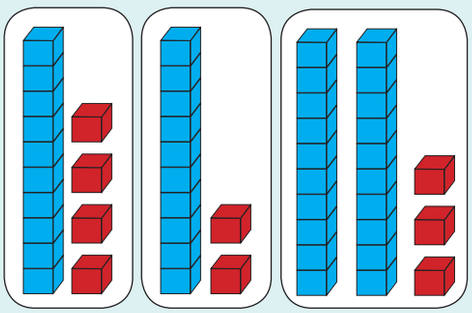

= □ □ + □ □ + □ □

= □ □ + □

= □

Ake usebenzise indlela yakho manje.



Susa lokhu okulandelayo.

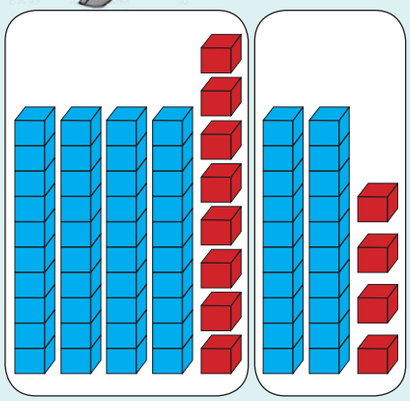

= 40 8 − 20 4

= 40 − 20 + 8 − 4

= 20 + 4

= 24

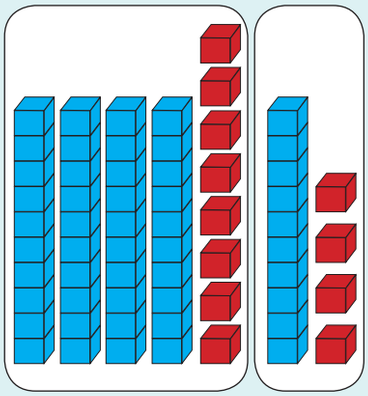

= ☐ ☐ − ☐ ☐

= ☐ − ☐ + ☐ − ☐

= ☐ + ☐

= ☐

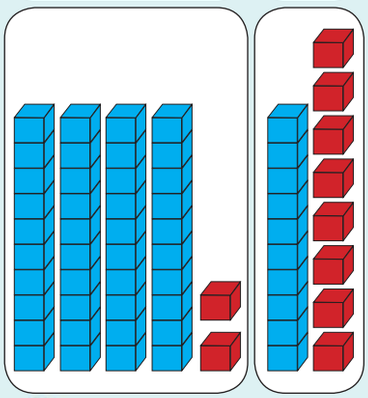

= ☐ ☐ − ☐ ☐

= ☐ − ☐ + ☐ − ☐

= ☐ − ☐

= ☐



Nginama-R10 ayiphepha, ama-R5 ayizinhlamvu, ama-R20 ayiphepha kanye nama-R2 awuhlamvu ebhange lami eliyingulubana. Ngonge malini?



Teacher:

Sign:

Date:

39a

Usuku:

Ukuhlanganisa



Hlanganisa izinombolo ebhulokhini ngalinye ubhale isamba.

1 10 5 10	2 10 6 20	3 20 5 20	4 20 4 10



Hlanganisa.

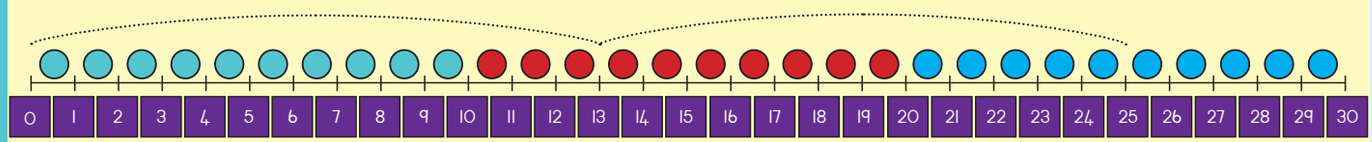

13 + 12 = ☐

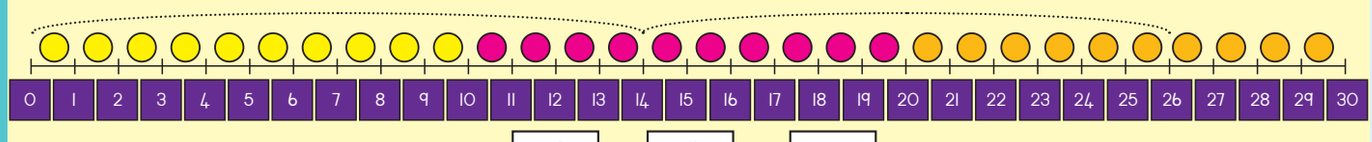

14 + 12 = ☐

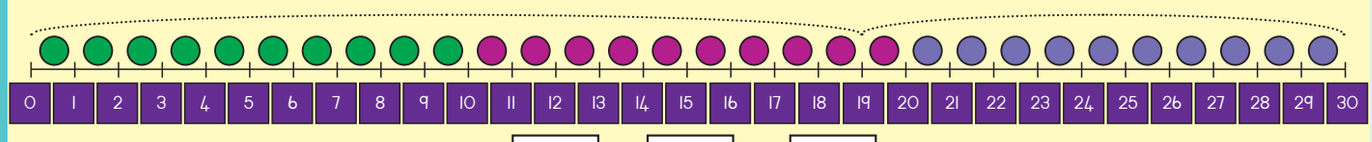

19 + 11 = ☐

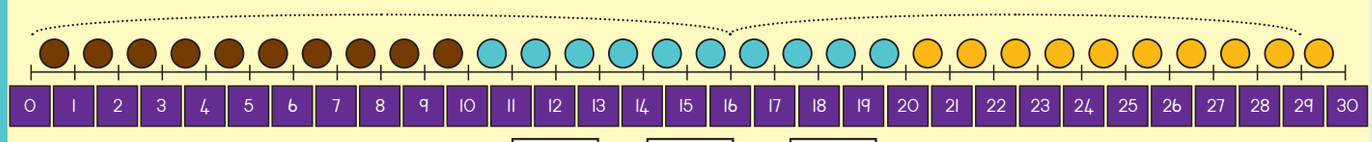

16 + 13 = ☐

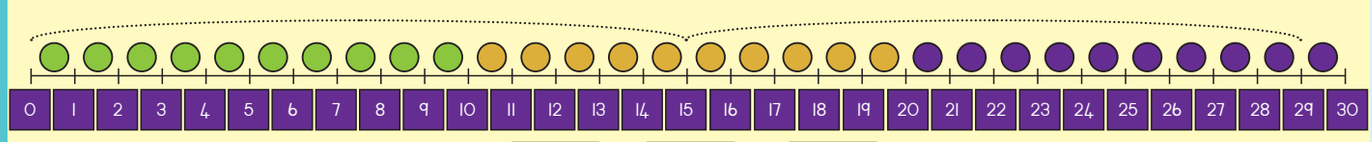

15 + 14 = ☐





3 Hlanganisa.

12 + 11

= 10 2 + 10 1

= 10 + 10 + 2 + 1

= 20 + 3

= 23

13 + 15

= ☐ ☐ + ☐ ☐

= ☐ + ☐ + ☐ + ☐

= ☐ + ☐

= ☐

26 + 12

= ☐ ☐ + ☐ ☐

= ☐ + ☐ + ☐ + ☐

= ☐ + ☐

= ☐

23 + 22

= ☐ ☐ + ☐ ☐

= ☐ + ☐ + ☐ + ☐

= ☐ + ☐

= ☐

24 + 13

= ☐ ☐ + ☐ ☐

= ☐ + ☐

= ☐

35 + 12

= ☐ ☐ + ☐ ☐

= ☐ + ☐

= ☐



4 UBetty uthenge amaswidi abiza ama-R36, kwathi akaSipho abiza R13. Basebenzise malini seyiyonke emaswidini?

Teacher:

Sign:

Date:

39b



Usuku:

Okunye ukuhlanganisa (kuyaqhutshwa)



Bhala isamba.

12 + 10 = ☐



15 + 10 = ☐



19 + 10 = ☐





Dweba ubuhlalu obunye bese uqedela isibalo.

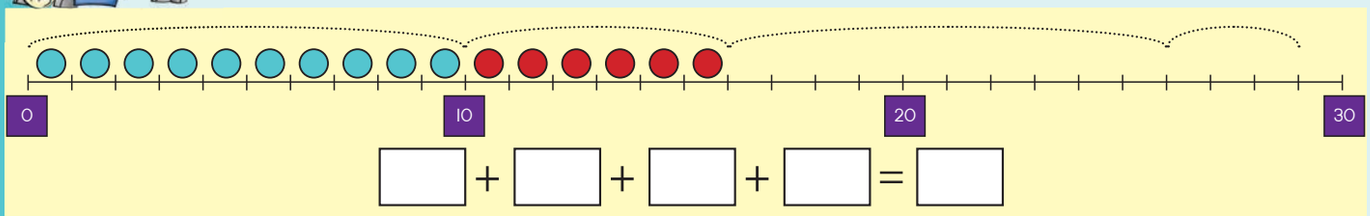

☐ + ☐ + ☐ + ☐ = ☐

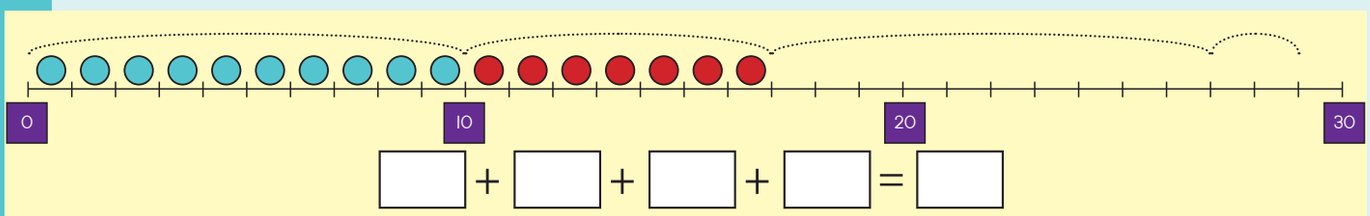

☐ + ☐ + ☐ + ☐ = ☐

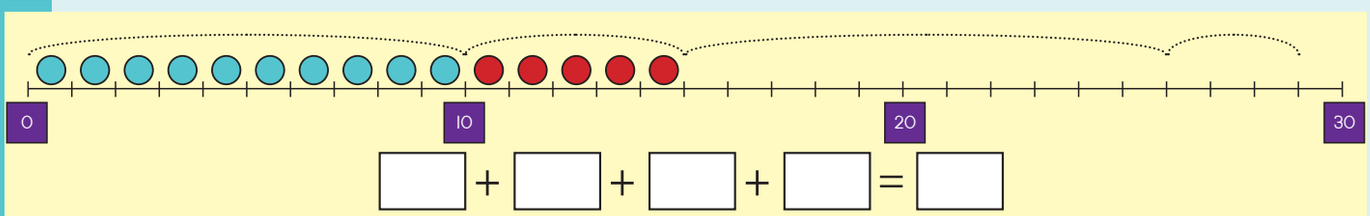

☐ + ☐ + ☐ + ☐ = ☐

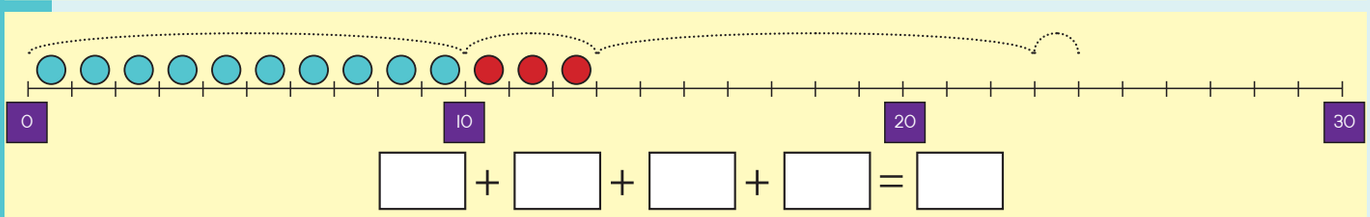

☐ + ☐ + ☐ + ☐ = ☐





Qedela.

28	+	11	=	2	8	+	10	+	1	=	38	+	1	=	39
34	+	12	=	3	4	+	10	+	2	=		+		=	
23	+	13	=	2	3	+	10	+	3	=		+		=	
35	+	12	=	3	5	+	10	+	2	=		+		=	
26	+	11	=	2	6	+	10	+	1	=		+		=	



Hlanganisa.

11 + 10 =		23 + 10 =		36+ 10 =	
28 + 10 =		37 + 10 =		12 + 10 =	
34 + 10 =		29 + 10 =		15 + 10 =	



Isamba sama-27 ne-16 ngama-?
Dweba isithombe ukukhombisa impendulo yakho.



Yenza esakho isibalo samagama usebenzisa izithombe.



Teacher:
Sign:
Date:

11 12 13 14 15 16 17 18 19 20

40

Usuku:

Ubude



Faka umbala empendulweni efanele ukukhombisa ukuthi le migqa yamabhulokhi mide noma mifushane, iphakeme noma mifushane, ibanzi noma iqoqene yini.

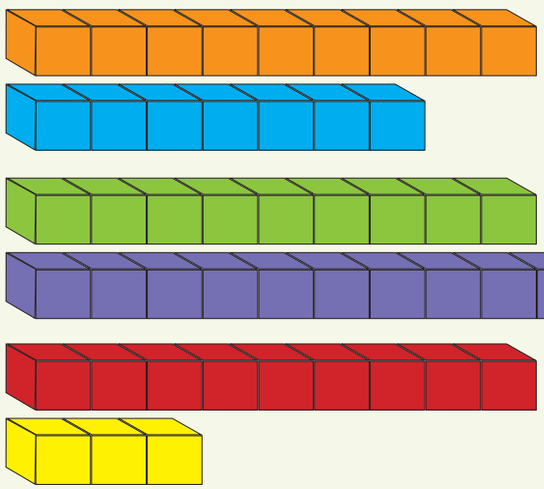

mifushane | mide

mifushane | mide

mifushane | mide

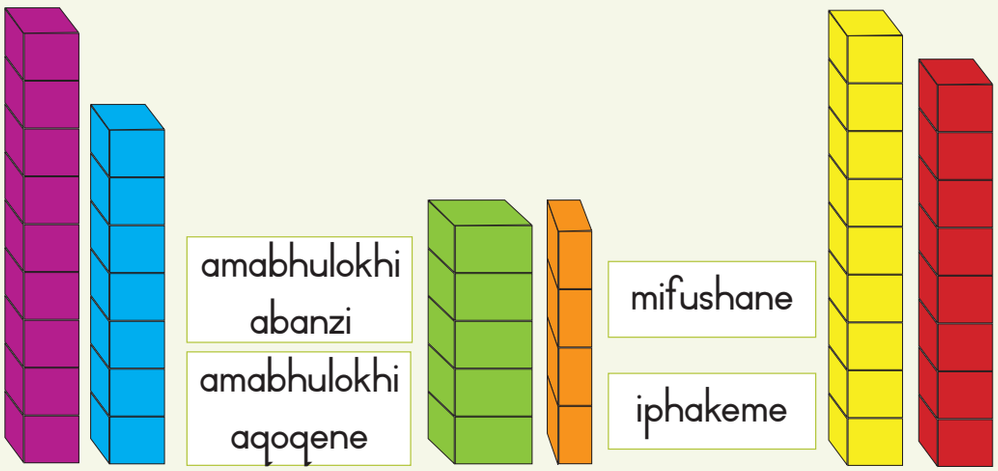

mifushane

iphakeme

amabhulokhi abanzi

amabhulokhi aqoqene

mifushane

iphakeme





2 Khombisa ukuthi yimuphi umfana ophakeme. Faka umbala empendulweni yakho ufane nombala wesikhindi somfana.



mfushane | uphakeme



uphakeme | mfushane



mfushane | uphakeme

3 Kala ubude benkundla yebhola usebenzisa izinyawo nezandla Zokusikwayo koku-1.

Inkundla ilingana nezandla ezingaki ubude? ____

Inkundla ilingana nezinyawo ezingaki ubude? ____

ubude



Teacher:

Sign:

Date:

11 12 13 14 15 16 17 18 19 20

41

Usuku:

Ukususa



Qondanisa amakhadi nezibalo zokususa.

10 − 2 = 8	10 − 8 = 2	10 − 7 = 3	10 − 5 = 5	10 − 3 = 7
17 − 7 = 10	12 − 2 = 10	15 − 5 = 10	13 − 3 = 10	18 − 8 = 10



Sebenzisa umugqa wezinombolo. Bhala isibalo sokususa.

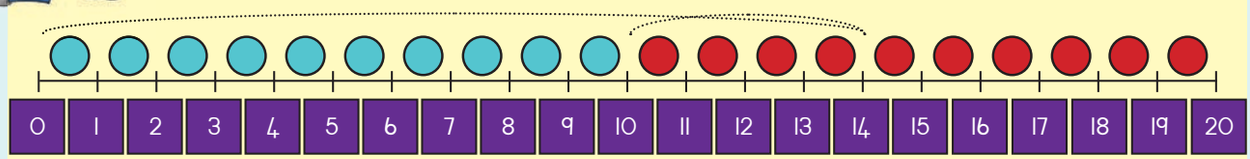

14 − 4 = 10

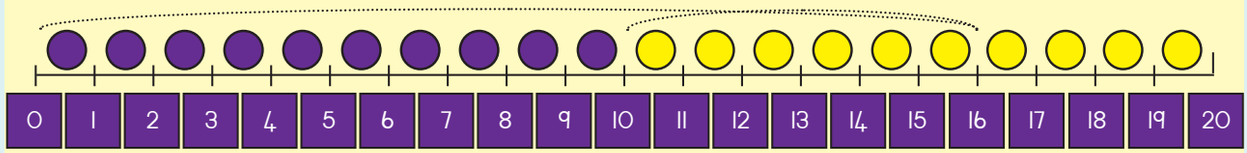

__ − __ = __

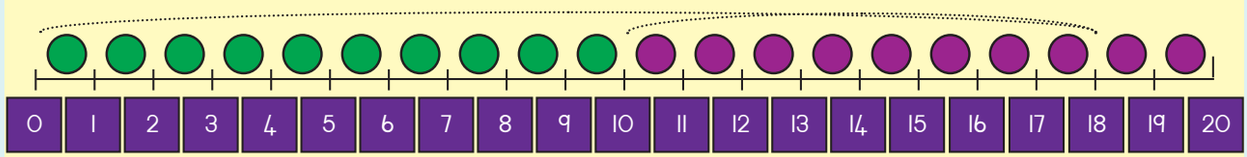

__ − __ = __

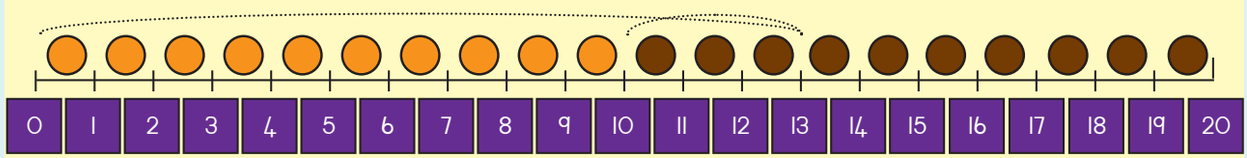

__ − __ = __







Susa.

10	3	− 3	=		
10	5	− 5	=		
10	1	− 1	=		
10	4	− 4	=		
10	9	− 9	=		

10	2	− 2	=		
10	7	− 7	=		
10	6	− 6	=		
10	8	− 8	=		
10	9	− 5	=		



Susa.

16 − 13

10	10		0	
6		− 3	=	3

16 − 13 = 3

14 − 12

10	10			
4		− 2	=	

14 − 12 = ☐

27 − 11

20	10			
7		− 1	=	

☐ − ☐ = ☐

35 − 13

30	10			
5		− 3	=	

☐ − ☐ = ☐

26 − 12

20	10			
6		− 2	=	

☐ − ☐ = ☐

48 − 11

40	10			
8		− 1	=	

☐ − ☐ = ☐



ULisa unezibali eziyi-17. Ulahlekelwe ngeziyi-8.





Usele nezibali ezingaki? ☐

Teacher:

Sign:

Date:

42a

Usuku:

Okunye ukususa

Susa izinombolo ezingezansi kwezingenhla.

10 − 7 = 17	20 − 2 =	30 − 8 =	40 − 9 =
10 − 5 = 15	10 − 1 =	10 − 5 =	10 − 4 =
2			

Sebenzisa umugqa wezinombolo. Bhala isibalo sokususa.

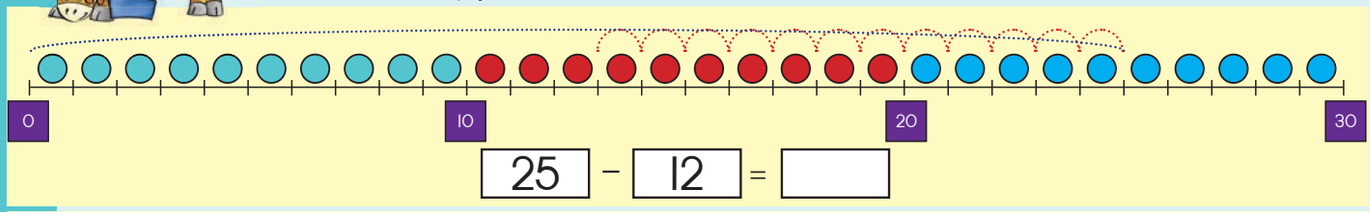

25 − 12 = ☐

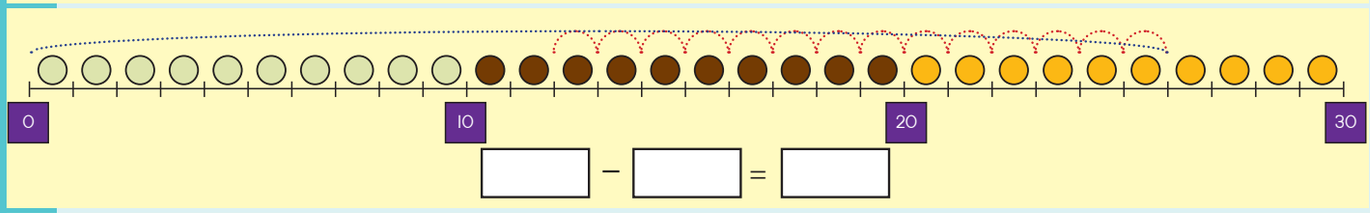

☐ − ☐ = ☐

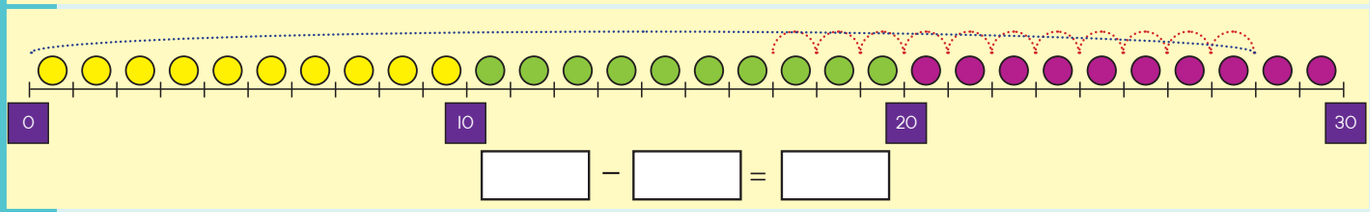

☐ − ☐ = ☐

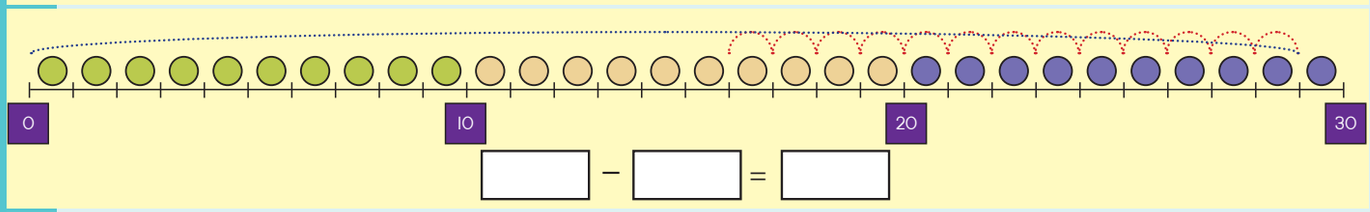

☐ − ☐ = ☐

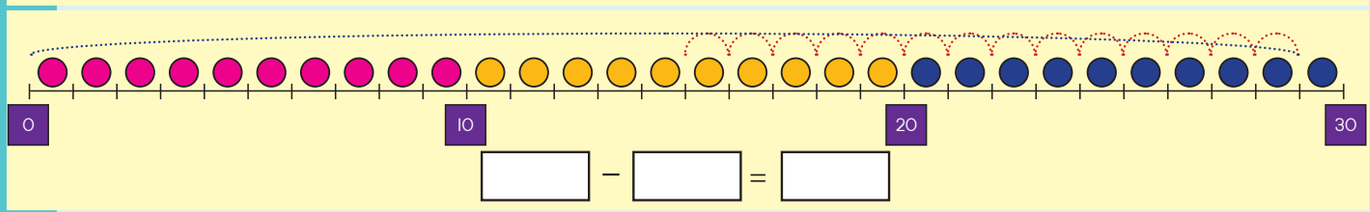

☐ − ☐ = ☐







Susa.

45 – 23

= 40 5 – 20 3

= 40 – 20 + 5 – 3

= 20 + 2

= 22

38 – 16

= ☐ ☐ – ☐ ☐

= ☐ – ☐ + ☐ – ☐

= ☐ + ☐

= ☐

29 – 14

= ☐ ☐ – ☐ ☐

= ☐ – ☐ + ☐ – ☐

= ☐ + ☐

= ☐

48 – 11

= ☐ ☐ – ☐ ☐

= ☐ – ☐ + ☐ – ☐

= ☐ + ☐

= ☐

35 – 23

= ☐ ☐ – ☐ ☐

= ☐ – ☐ + ☐ – ☐

= ☐ + ☐

= ☐

38 – 15

= ☐ ☐ – ☐ ☐

= ☐ – ☐ + ☐ – ☐

= ☐ + ☐

= ☐



Teacher:

Sign:

Date:

11 12 13 14 15 16 17 18 19 20

42b

Usuku:

Okunye futhi ukususa

Yenza isibalo sokususa ufake impendulo ebhokisini elingenalutho.

2 2 − 1 0 = ☐



2 5 − 1 0 = ☐

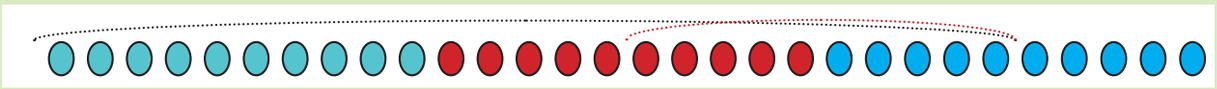

2 9 − 1 0 = ☐

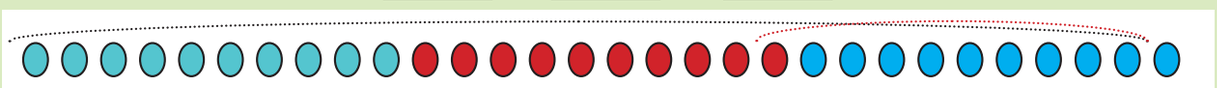

Qedela izibalo zokususa.

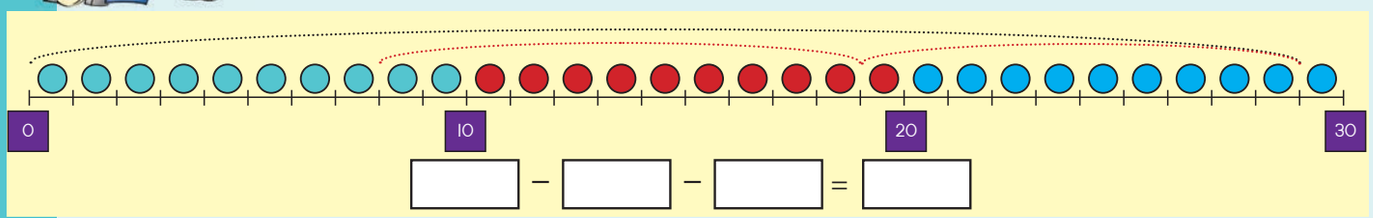

☐ − ☐ − ☐ = ☐

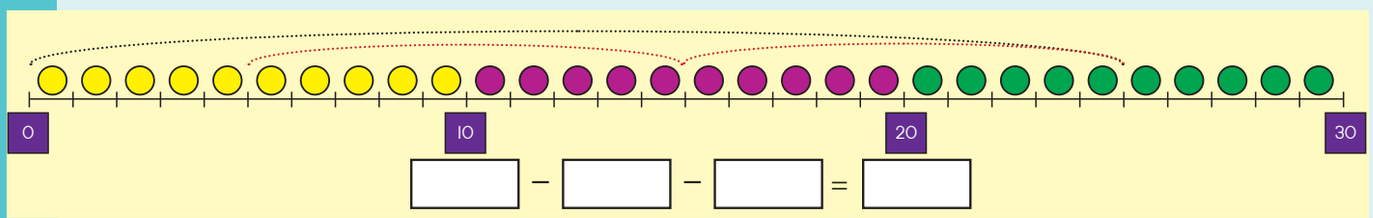

☐ − ☐ − ☐ = ☐

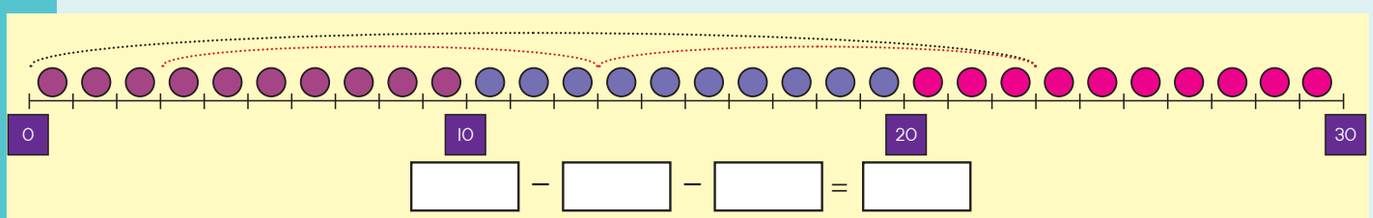

☐ − ☐ − ☐ = ☐

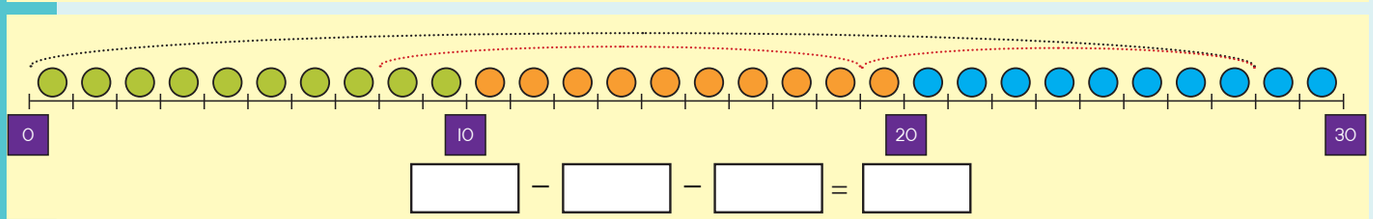

☐ − ☐ − ☐ = ☐







Qedela.

46	−	13	=		49	−	23	=
38	−	14	=		27	−	16	=
25	−	11	=		46	−	32	=



Susa.

21 − 10 =	43 − 10 =	16 − 10 =
28 − 10 =	27 − 10 =	22 − 10 =
34 − 10 =	37 − 10 =	45 − 10 =



Umahluko phakathi kwama-35 nama-20 yi-? Dweba isithombe ukukhombisa impendulo yakho.

35 − 20 = _____



Yenza esakho isibalo samagama usebenzisa izithombe.





Teacher:
Sign:
Date:

11 12 13 14 15 16 17 18 19 20

43

Usuku:

Kuyasinda, kulula

1 Buka izithombe bese uphendula imibuzo.

Yikuphi okulula kakhulu, yikuphi okusinda kakhulu?





2 Namathisela noma udwebe izithombe zalokhu:

Izinto ezisindayo	Izinto ezilula



Umbala ophuzi ukhombisa ukuthi into ilula kanti osasibhakabhaka ukhombisa ukuthi iyasinda. Bhala "kulula" noma "kuyasinda".



kulula











Dweba noma unamathisele izinto ulandele okukhonjiswa yisikali.

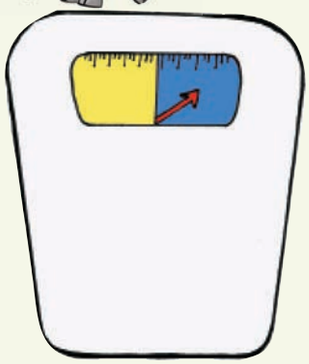

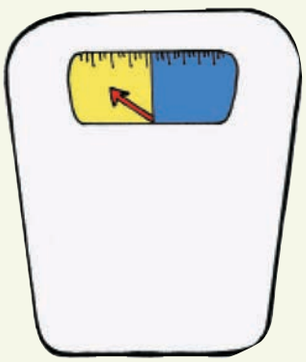

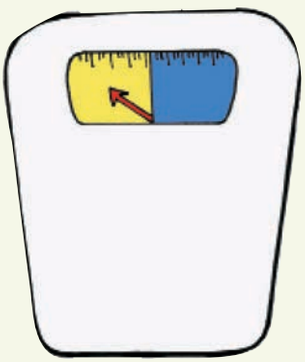

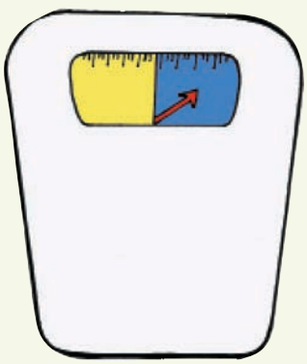

Teacher:
Sign:
Date:

11 12 13 14 15 16 17 18 19 20

44

Usuku:

Amaphethini ezinombolo: Okuhamba ngakubili

1 Masibale ngakubili.





2 Dweba noma unamathisele izithombe zezinto ezihamba ngazimbili.

3 Sikuqalele iphethini. Liqedele.

1	2	3	4	5	6	7	8	9	10
11	12	13	14	15	16	17	18	19	20
21	22	23	24	25	26	27	28	29	30
31	32	33	34	35	36	37	38	39	40
41	42	43	44	45	46	47	48	49	50
51	52	53	54	55	56	57	58	59	60
61	62	63	64	65	66	67	68	69	70
71	72	73	74	75	76	77	78	79	80
81	82	83	84	85	86	87	88	89	90
91	92	93	94	95	96	97	98	99	100

1 2 3 4 5 6 7 8 9 10



Sebenzisa umugqa wezinombolo ukubhala leli phethini.

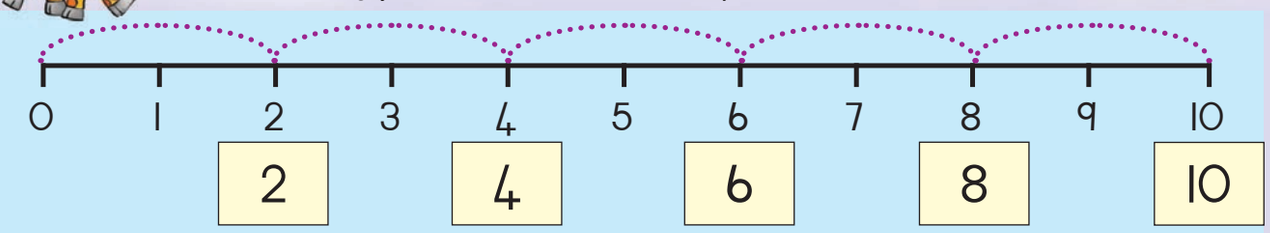

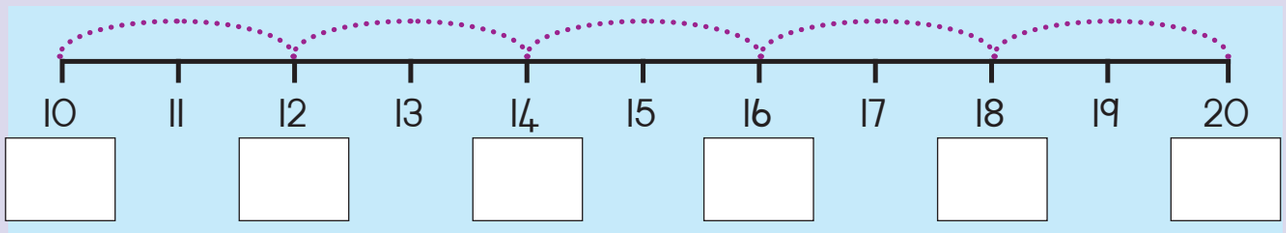

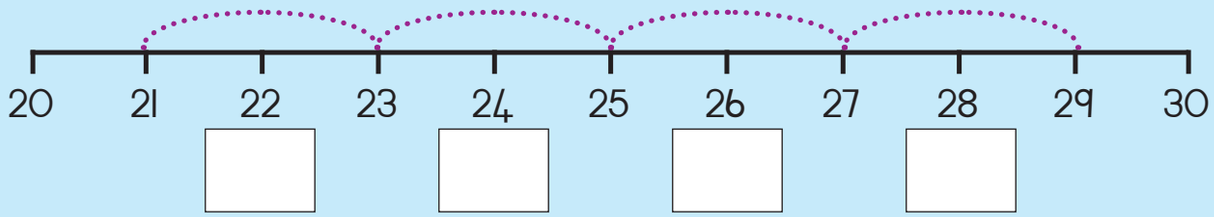

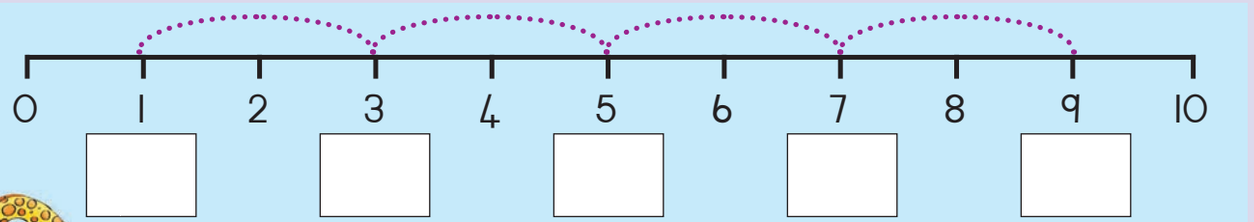

Qedela lokhu okulandelayo.

2, 4, 6, __, __, __	13, 15, 17, __, __, __	26, 24, 22, __, __, __
62, 64, 66, __, __, __	55, 57, 59, __, __, __	11, 9, 7, __, __, __
44, 46, 48, __, __, __	10, 8, 6, __, __, __	29, 27, 25, __, __, __
1, 3, 5, __, __, __	98, 96, 94, __, __, __	95, 93, 91, __, __, __

2 4 6 8 10 12 14 16 18 20

Teacher:
Sign:
Date:

11 12 13 14 15 16 17 18 19 20

45

Usuku:

Ukuphinda kabili

1 Buka ithebhula lokuqala nelesibili. Kwenzekeni?





2 Hlanganisa amachashazi bese ubhala isibalo.



Sebenzisa umugqa wezinombolo ukubhala isibalo.

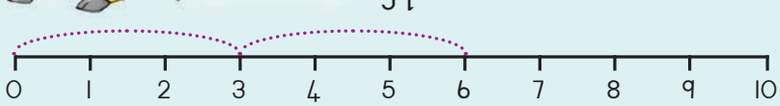

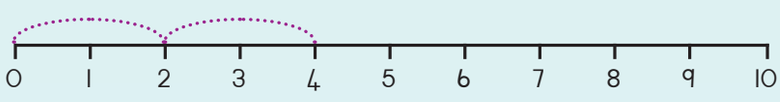

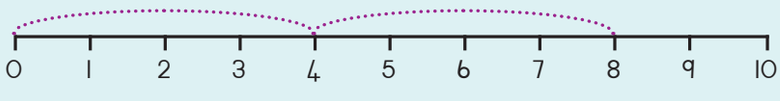

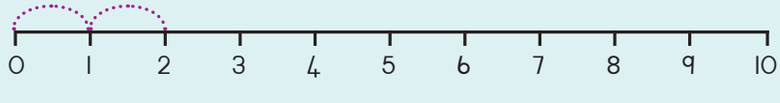

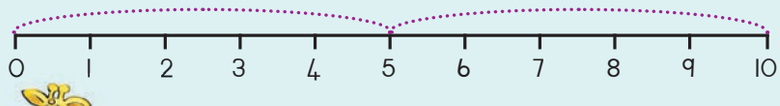

0 1 2 3 4 5 6 7 8 9 10

$\square + \square = \square$

$\square + \square = \square$

$\square + \square = \square$

$\square + \square = \square$

$\square + \square = \square$

Phinda kabili lezi zinombolo ezilandelayo.

Phinda kabili oku-1	$1 + 1 = 2$	$2 \times 1 = 2$
Phinda kabili oku-2	$\square + \square = \square$	$2 \times \square = \square$
Phinda kabili oku-3	$\square + \square = \square$	$2 \times \square = \square$
Phinda kabili oku-4	$\square + \square = \square$	$2 \times \square = \square$
Phinda kabili oku-5	$\square + \square = \square$	$2 \times \square = \square$

Nginama-R5. Umngani wami unaleli nani eliphindeke kabili. Unamalini seyiyonke?

Teacher:

Sign:

Date:

11 12 13 14 15 16 17 18 19 20

46

Usuku:

Phinda kabili futhi

1 Buka ithebhula lokuqala nelesibili. Kwenzekeni?



2 Hlanganisa amachashazi bese ubhala isibalo.

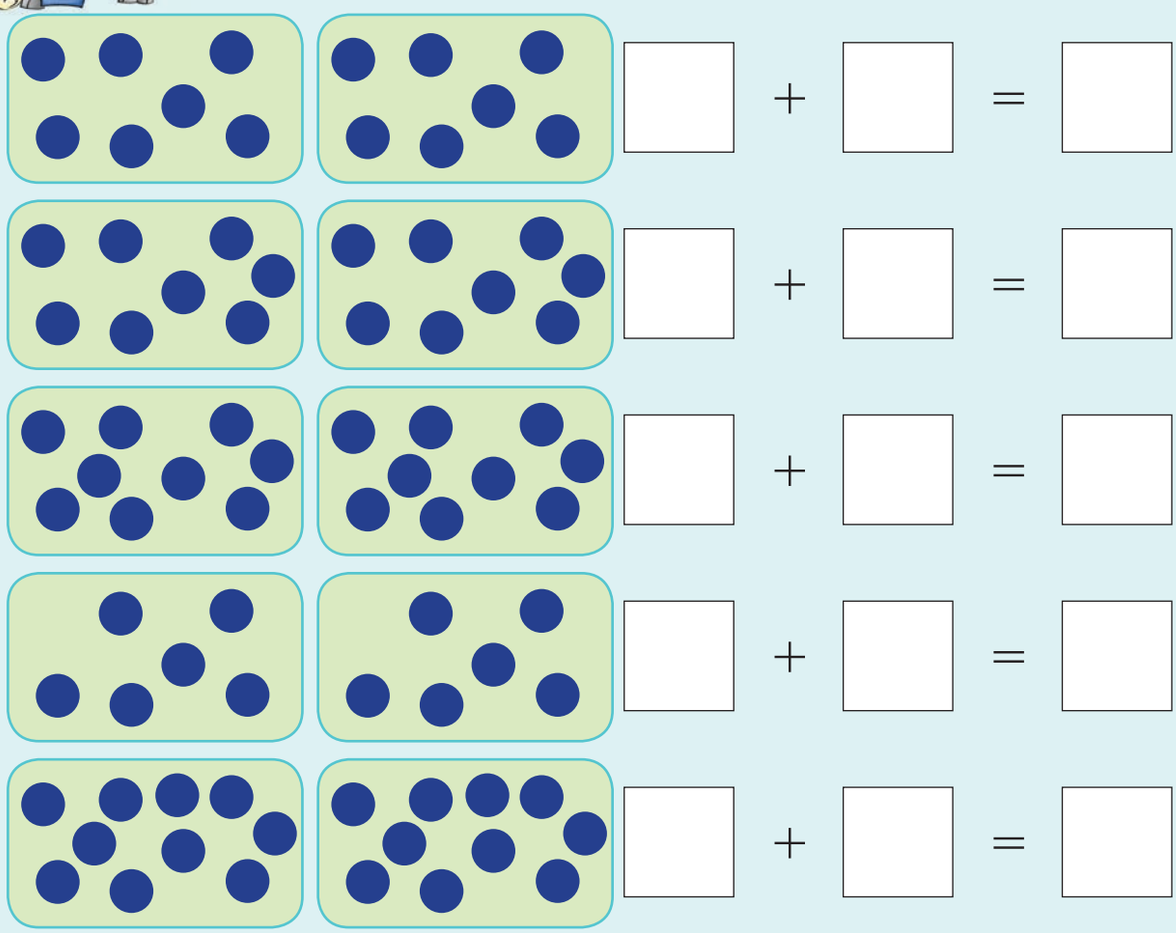





Sebenzisa umugqa wezinombolo ukubhala isibalo.

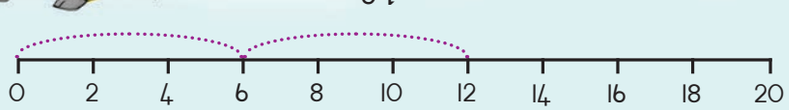

□ + □ = □

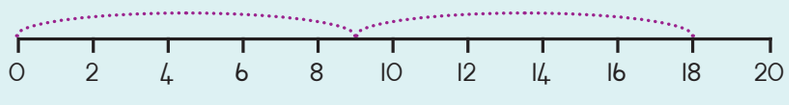

□ + □ = □

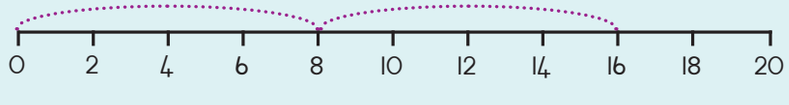

□ + □ = □

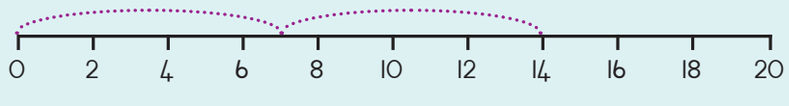

□ + □ = □

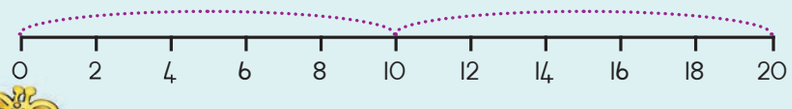

□ + □ = □

Phinda kabili lezi zinombolo ezilandelayo.

Phinda kabili okuyi-6	□ + □ = □	2 × 6 = 12
Phinda kabili okuyi-7	□ + □ = □	2 × □ = □
Phinda kabili okuyi-8	□ + □ = □	2 × □ = □
Phinda kabili okuyi-9	□ + □ = □	2 × □ = □
Phinda kabili okuyi-10	□ + □ = □	2 × □ = □

Umngani wami unezimabule eziyi-9. Ngineziphindwe kabili kuzo. Nginezimabule ezingaki sezizonke?

Teacher:
Sign:
Date:

47



Usuku:

.....

Phinda kabili

Phinda kabili okuyi-8

1 2 3 4 5 6 7 8 1 2 3 4 5 6 7 8

1 2 3 4 5 6 7 8 9 10 11 12 13 14 15 16

Phinda kabili okuyi-9

1 2 3 4 5 6 7 8 9 1 2 3 4 5 6 7 8 9

1 2 3 4 5 6 7 8 9 10 11 12 13 14 15 16 17 18



Kokelezela ukuze izinombolo ziphindeke kabili. Sikwenzele okokuqala.

Phinda kabili oku-5



5 + 5 = ☐

Phinda kabili okuyi-6



☐ + ☐ = ☐

Phinda kabili okuyi-7



☐ + ☐ = ☐

Phinda kabili okuyi-8



☐ + ☐ = ☐

Phinda kabili okuyi-9



☐ + ☐ = ☐





Phinda kabili lezi zinombolo. Faka umbala emabhulokhini ukukhombisa izinombolo.

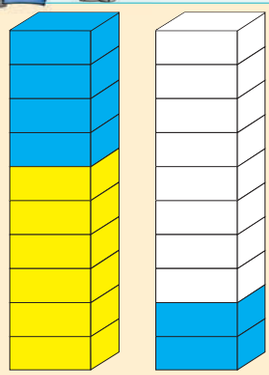

Phinda kabili okuyi-6

6 + 6 = ☐

2 × 6 = ☐

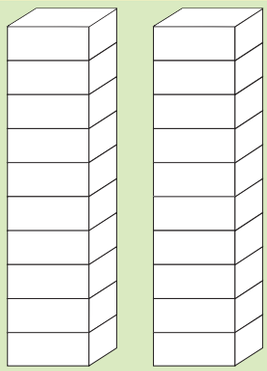

Phinda kabili okuyi-8

☐ + ☐ = ☐

2 × ☐ = ☐

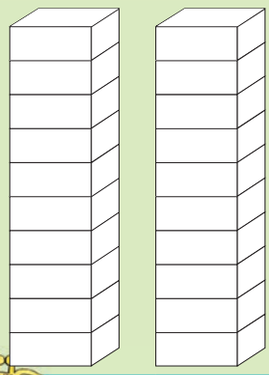

Phinda kabili okuyi-7

☐ + ☐ = ☐

2 × ☐ = ☐

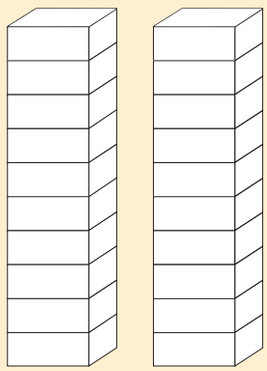

Phinda kabili okuyi-9

☐ + ☐ = ☐

2 × ☐ = ☐

Phinda kabili lokhu okulandelayo.

Phinda kabili okuyi-7	☐ + ☐ = ☐	2 × ☐ = ☐
Phinda kabili okuyi-9	☐ + ☐ = ☐	2 × ☐ = ☐
Phinda kabili okuyi-6	☐ + ☐ = ☐	2 × ☐ = ☐
Phinda kabili okuyi-8	☐ + ☐ = ☐	2 × ☐ = ☐
Phinda kabili okuyi-10	☐ + ☐ = ☐	2 × ☐ = ☐

Ngizuze amaphuzu ayi-8. Umngani wami uzuze aphindwe kabili kulawo. Mangaki amaphuzu umngani wami awazuzile?

Teacher:

Sign:

Date:

11 12 13 14 15 16 17 18 19 20

48

Usuku:

Ukuphinda kabili kuyaqhutshwa

Phinda kabili okuyi-12

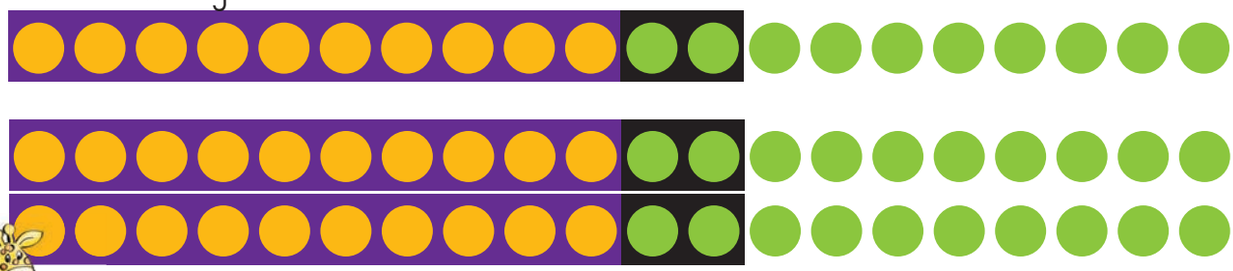



Kokelezela ubuhlalu ukuze kuphindeke izinombolo kabili. Sikwenzele okokuqala.

Phinda kabili okuyi-13

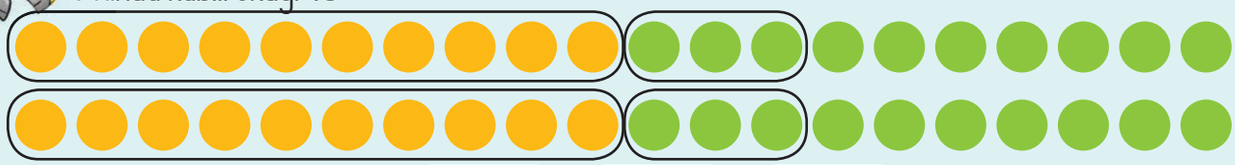

Phinda kabili okuyi-15 ☐ + ☐ = ☐

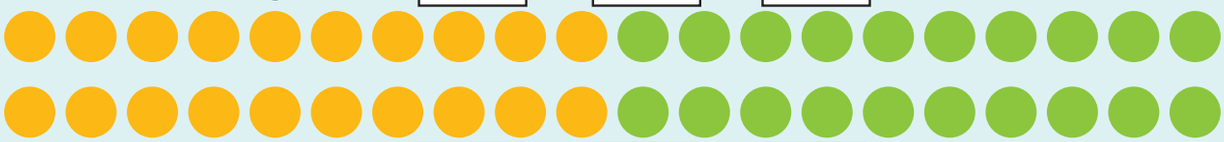

Phinda kabili okuyi-14 ☐ + ☐ = ☐



Phinda kabili okuyi-11 ☐ + ☐ = ☐



Phinda kabili okuyi-16 ☐ + ☐ = ☐

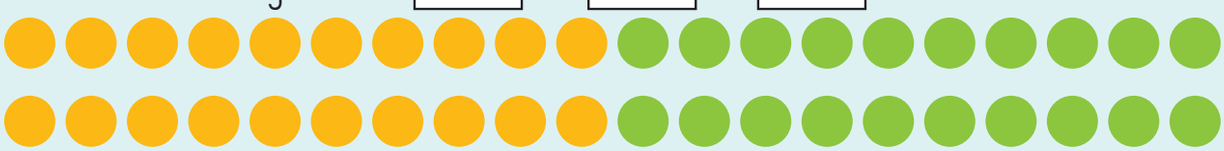

☐ + ☐ = ☐





Phinda kabili lezi zinombolo. Faka umbala emabhulokhini ukukhombisa izinombolo.

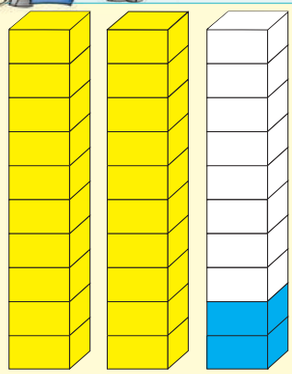

Phinda kabili oku-11

II + II = ☐

2 × II = ☐



Phinda kabili okuyi-13

☐ + ☐ = ☐

2 × ☐ = ☐

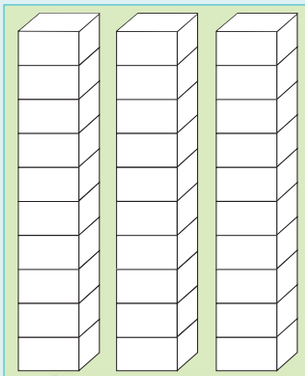

Phinda kabili okuyi-14

☐ + ☐ = ☐

2 × ☐ = ☐

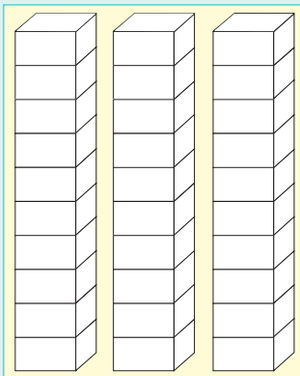

Phinda kabili okuyi-15

☐ + ☐ = ☐

2 × ☐ = ☐

Phinda kabili lokhu okulandelayo.

Phinda kabili okuyi-11	☐ + ☐ = ☐	2 × ☐ = ☐
Phinda kabili okuyi-13	☐ + ☐ = ☐	2 × ☐ = ☐
Phinda kabili okuyi-16	☐ + ☐ = ☐	2 × ☐ = ☐
Phinda kabili okuyi-17	☐ + ☐ = ☐	2 × ☐ = ☐
Phinda kabili okuyi-18	☐ + ☐ = ☐	☐ × ☐ = ☐

Ngidle amakhekhe ayi-14 ngenkathi kunomncintiswano wokudla amakhekhe. Lona onqobile udle aphindwe kabili kwadliwe yimi. Uhlabane ngokungakanani lo onqobile?

Teacher:

Sign:

Date:

11 12 13 14 15 16 17 18 19 20

Usuku:

.....

Izitsha nomthamo

1 Xoxa ngezitsha ezisemadeskini.



2 Yisho ukuthi isitsha sigcwele yini noma kasinalutho.





Faka umbala ukukhombisa ukuthi lezi zitsha zi-_____.

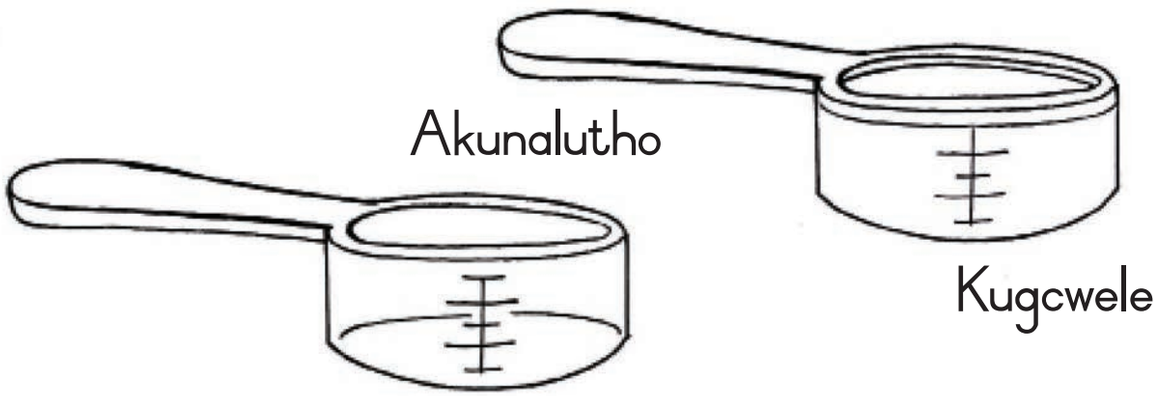

Dweba ezakho izitsha ufake umbala kwezikuphethe.

Akunalutho	Kugcwele
Akunalutho	Kugcwele

Teacher:
Sign:
Date:

50

Usuku:

Ukuphindaphinda: × 3

1 Mangaki amaswidi etafuleni ngalinye?



2 Qedela lokhu okulandelayo:

amaqoqo a-2 anezinto ezi-3: 3 + 3 = ; 2 × 3 = ☐

amaqoqo a-5 anezinto ezi-3: 3 + 3 + 3 + 3 + 3 = ; 5 × 3 = ☐

amaqoqo a-4 anezinto ezi-3: 3 + 3 + 3 + 3 = ; 4 × 3 = ☐

amaqoqo ayi-6 anezinto ezi-3: 3 + 3 + 3 + 3 + 3 + 3 = ; 6 × 3 = ☐

amaqoqo okuyi-7 anezinto ezi-3: 3 + 3 + 3 + 3 + 3 + 3 + 3 = 7 × 3 = ☐

3 Yenza umdwebo ngalokhu okulandelayo.

amaqoqo a-3 anezinto ezi-3	amaqoqo a-4 anezinto ezi-3	amaqoqo a-5 anezinto ezi-3



Yenza umdwebo ngalokhu okulandelayo.

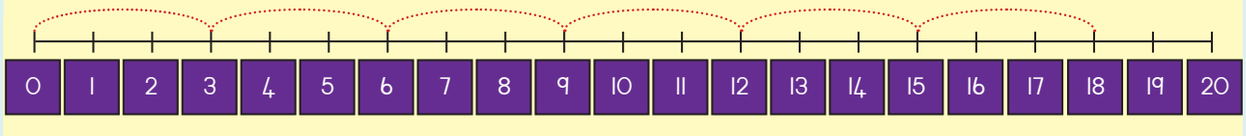

3, 6, 9, 12, ___, ___

$3 + 3 + 3 + 3 + 3 + 3 =$ ☐

amaqoqo ayi-6 anezinto ezi- ☐ = ☐

$6 \times 3 =$ ☐

Umdwebo



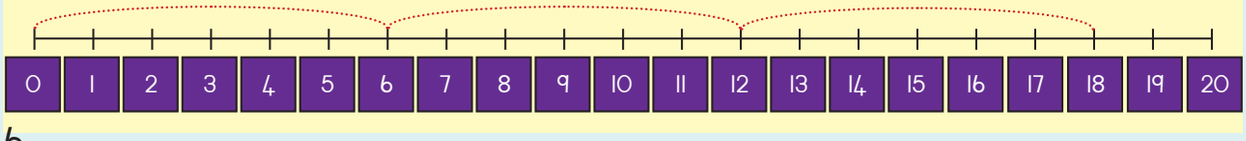

6, ___, ___

$6 +$ ☐ $+$ ☐ $=$ ☐

amaqoqo a-3 anezinto ezi- ☐ = ☐

$3 \times$ ☐ $=$ ☐

Umdwebo

Ibhodwe lokupheka linemilenze emithathu. Amabhodwe okupheka uma eyi-7 anemilenze emingaki? ☐



3 6 9 12 15 18

21 24 27 30 33

Teacher:

Sign:

Date:

51

Usuku:



Amaphethini ezinombolo: Okungakuthathu

Masibale ngakuthathu.





Dweba noma unamathisele izithombe zezinto ezihamba ngazintathu.

Sikuqalele iphethini. Liqedele.

1	2	3	4	5	6	7	8	9	10
11	12	13	14	15	16	17	18	19	20
21	22	23	24	25	26	27	28	29	30
31	32	33	34	35	36	37	38	39	40
41	42	43	44	45	46	47	48	49	50
51	52	53	54	55	56	57	58	59	60
61	62	63	64	65	66	67	68	69	70
71	72	73	74	75	76	77	78	79	80
81	82	83	84	85	86	87	88	89	90
91	92	93	94	95	96	97	98	99	100





Sebenzisa umugqa wezinombolo ukubhala iphethini.

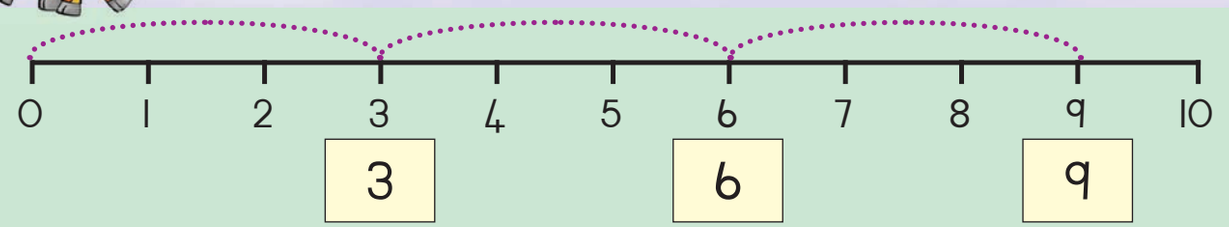

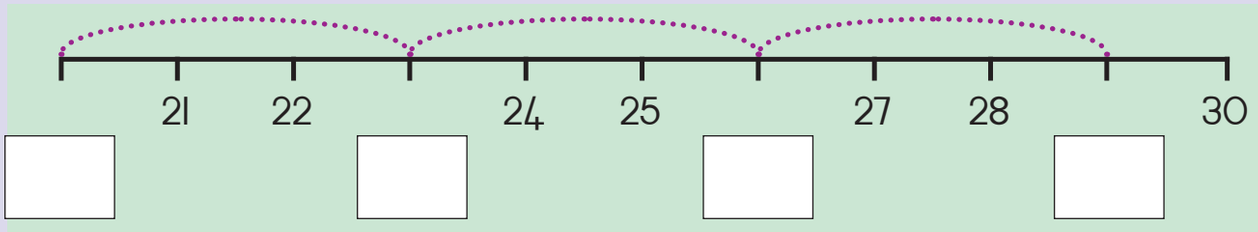

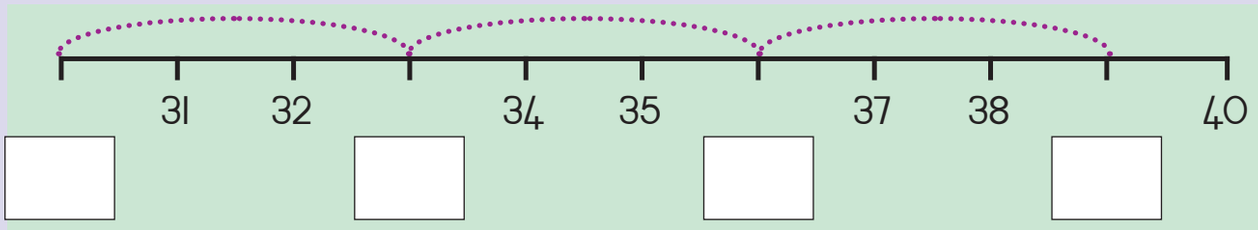

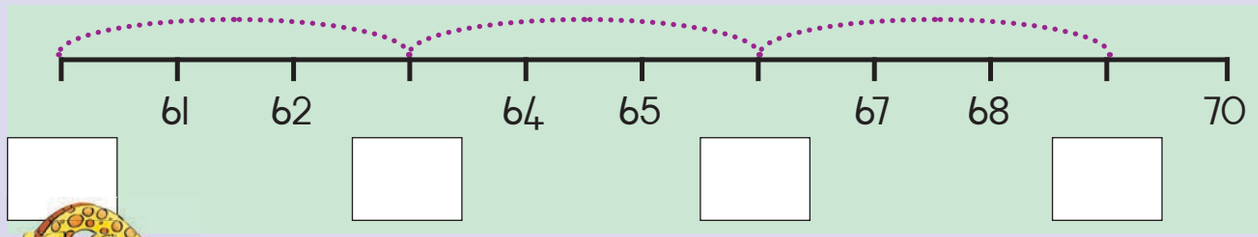

Qedela lokhu okulandelayo.

3, 6, 9, __, __, __	1, 4, 7, __, __, __	99, 96, 93, __, __, __
36, 39, 42, __, __, __	22, 25, 28, __, __, __	66, 63, 60, __, __, __
12, 15, 18, __, __, __	15, 12, 9, __, __, __	40, 37, 34, __, __, __

Kunawosondo-ntathu abayi-10 esikoleni sabancane. Kunamasondo amangaki awosondo-ntathu esewonke?

Teacher:
Sign:
Date:

11 12 13 14 15 16 17 18 19 20



Usuku:

Ukuphindaphinda: × 4



Mangaki amaswidi etafuleni ngalinye?





Qedela lokhu okulandelayo.

amaqoqo a-3 anezinto ezi-4	4 + 4 + 4 =	3 × 4 =
amaqoqo a-2 anezinto ezi-4	4 + 4 =	2 × 4 =
amaqoqo a-4 anezinto ezi-4	4 + 4 + 4 + 4 =	4 × 4 =
amaqoqo ayi-6 anezinto ezi-4	4 + 4 + 4 + 4 + 4 + 4 =	6 × 4 =
amaqoqo ayi-7 anezinto ezi-4	4 + 4 + 4 + 4 + 4 + 4 + 4 =	7 × 4 =



Yenza umdwebo ngalokhu okulandelayo.

amaqoqo a-3 anezinto ezi-4	amaqoqo a-4 anezinto ezi-4	amaqoqo a-5 anezinto ezi-4





Yenza umdwebo ngalokhu okulandelayo.

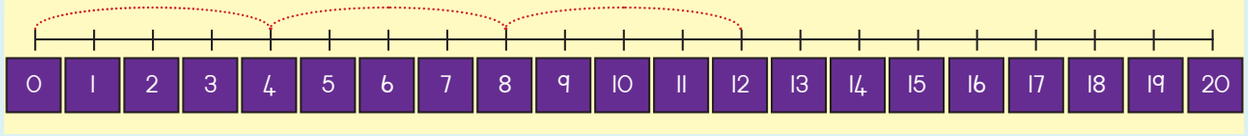

4, 8, ___

$4 + 4 + 4 =$ ☐

amaqoqo a-3 anezinto ezi-4 = ☐

$3 \times 4 =$ ☐

Umdwebo



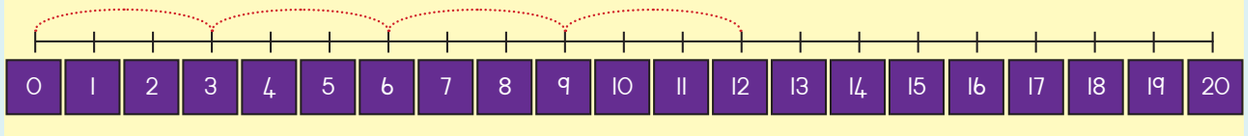

3, 6, 9, ___

$3 + 3 + 3 + 3 =$ ☐

amaqoqo anoku-4 anezinto ezi-4 ☐ = ☐

$4 \times$ ☐ = ☐

Umdwebo



Ihhashi linemilenze emi-4. Anemilenze emingaki seyiyonke amahhashi ama-3. ☐



4 8 12 16 20 24

28 32 36 40

Teacher:

Sign:

Date:

11 12 13 14 15 16 17 18 19 20

53



Usuku:

Amaphethini ezinombolo: Okuhamba ngakune

1 Masibale ngakune.





2 Dweba noma unamathisele izinto ezihamba ngazine.

3 Sikuqalele iphethini. Liqedele.

1	2	3	4	5	6	7	8	9	10
11	12	13	14	15	16	17	18	19	20
21	22	23	24	25	26	27	28	29	30
31	32	33	34	35	36	37	38	39	40
41	42	43	44	45	46	47	48	49	50
51	52	53	54	55	56	57	58	59	60
61	62	63	64	65	66	67	68	69	70
71	72	73	74	75	76	77	78	79	80
81	82	83	84	85	86	87	88	89	90
91	92	93	94	95	96	97	98	99	100





Sebenzisa umugqa wezinombolo ukubhala iphethini.

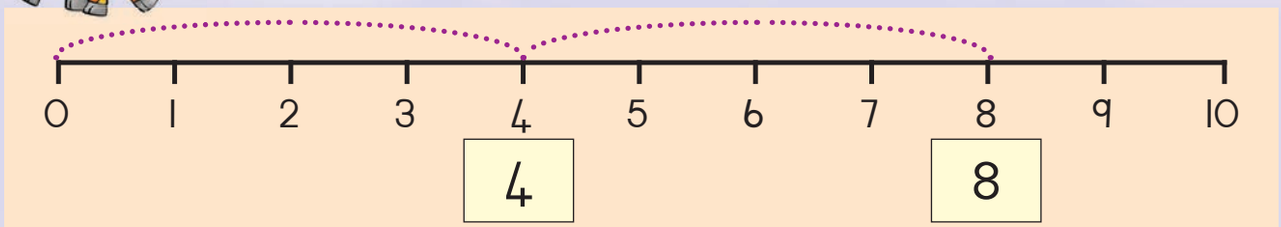

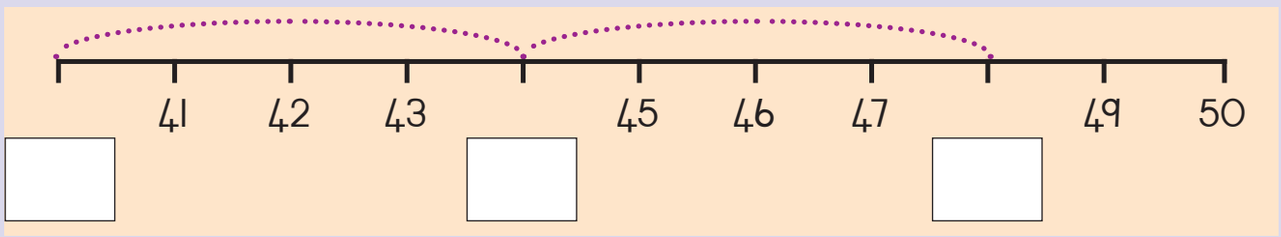

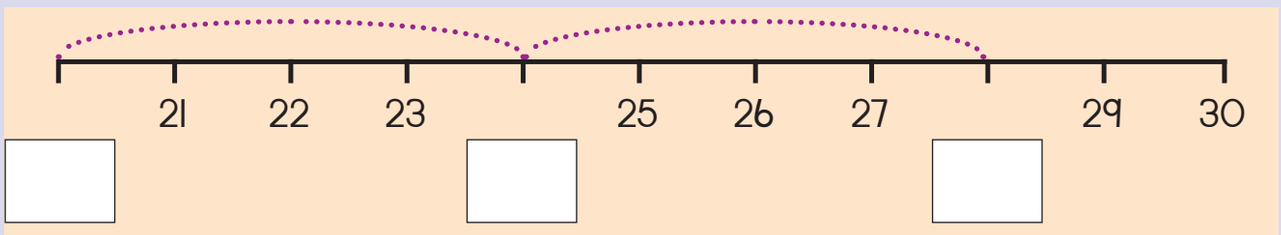

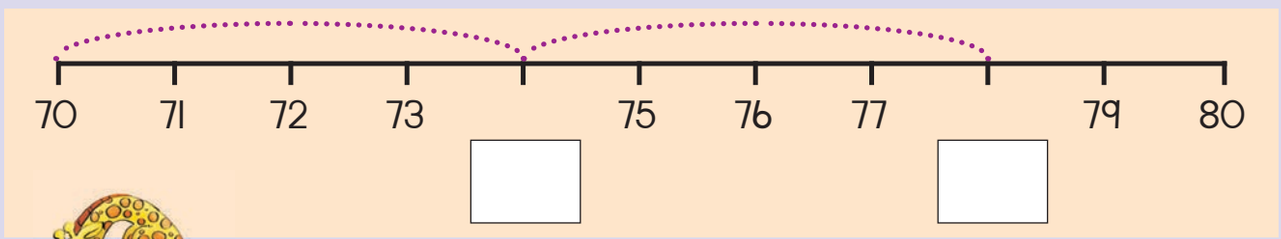

Qedela lokhu okulandelayo.

4, 8, 12, __, __, __	1, 5, 9, __, __, __	48, 44, 40, __, __, __
28, 32, 36, __, __, __	42, 46, 50, __, __, __	60, 56, 52, __, __, __
12, 16, 20, __, __, __	20, 16, 12, __, __, __	70, 66, 62, __, __, __

Kunamakhekhe amane ephaketheni. Ngithengise amaphakethe ayi-9.
Mangaki amakhekhe engiwathengisile esewonke?

Teacher:
Sign:
Date:

11 12 13 14 15 16 17 18 19 20



Usuku:

Izindaba zokuphindaphinda ziyaqhutshwa

Yenza indaba yakho usebenzise amagama athi amehlo, imilenze, izandla, izinyawo, izilwane, abantu. Faka inombolo kulokhu ngakunye.



Ikati linamehlo ama-2. Mangaki amehlo esewonke uma amakati e-4?



Faka umbala emehlweni amakati.

Wukhombise ezibalini.

Wukhombise emgqeni wezinombolo.

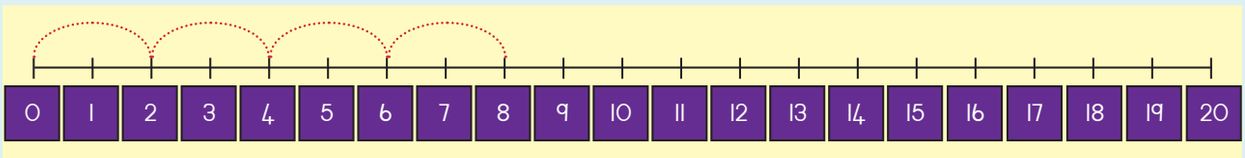

□ + □ + □ + □ = □

□ × □ = □







Usondo-ntathu unamasondo ama-3. Mangaki esewonke amasondo kosondo-ntathu aba-5?



Faka umbala emasondweni osondo-ntathu.

Wukhombise ezibalini.

Wukhombise emgqeni wezinombolo.

0	1	2	3	4	5	6	7	8	9	10	11	12	13	14	15	16	17	18	19	20

+ = ☐ ☐ × ☐ = ☐



Inja inemilenze emi-4. Mingaki imilenze seyiyonke uma izinja zi-4?



Faka umbala emilenzeni yenja.

Wukhombise ezibalini.

Wukhombise emgqeni wezinombolo.

0	1	2	3	4	5	6	7	8	9	10	11	12	13	14	15	16	17	18	19	20

+ = ☐ ☐ × ☐ = ☐

Teacher:
Sign:
Date:

11 12 13 14 15 16 17 18 19 20

55



Usuku:

.....

Amahora

1 Khuluma ngewashi.



Uluthi olufushane lusikhombisa amahora.

Kuleli washi lusikhombisa ihora lesi-7.

Uthi lwewashi luyajikeleza, lujikeleze lujikeleze,
lujikeleze lujikeleze, lujikeleze lujikeleze
Uthi lwewashi luyajikeleza lujikeleze,
bese lusitshela isikhathi.

2 Lusikhombisani uthi olufushane?



☐ ihora ☐ amahora ☐ amahora ☐ amahora



☐ amahora ☐ amahora ☐ amahora ☐ amahora



☐ amahora ☐ amahora ☐ amahora ☐ amahora





3 Dweba uthi olufushane.

amahora a-4



ihora eli-1



amahora ayi-11



amahora ayi-7



amahora ayi-9



amahora ayi-10



amahora a-2



amahora a-5



amahora a-3



amahora ayi-6



amahora ayi-8



amahora ayi-12



4 Yini ethatha ihora uma yenziwa? Faka umbala empendulweni efanele.



ukwenza umsebenzi wesikole ekhaya



ukulala



ukuxubha amazinyo

Teacher:
Sign:
Date:

11 12 13 14 15 16 17 18 19 20



Usuku:

.....

Amaphethini ezinombolo: Okuhamba ngakuhlanu

1 Masibale ngakuhlanu.





2 Dweba noma unamathisele izinto ezihamba ngazinhlanu.

3 Sikuqalele iphethini. Liqedele.

1	2	3	4	5	6	7	8	9	10
11	12	13	14	15	16	17	18	19	20
21	22	23	24	25	26	27	28	29	30
31	32	33	34	35	36	37	38	39	40
41	42	43	44	45	46	47	48	49	50
51	52	53	54	55	56	57	58	59	60
61	62	63	64	65	66	67	68	69	70
71	72	73	74	75	76	77	78	79	80
81	82	83	84	85	86	87	88	89	90
91	92	93	94	95	96	97	98	99	100



Sebenzisa umugqa wezinombolo ukubhala iphethini.

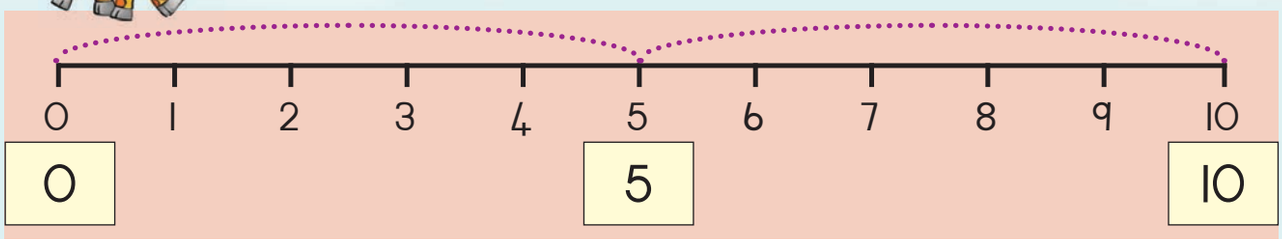

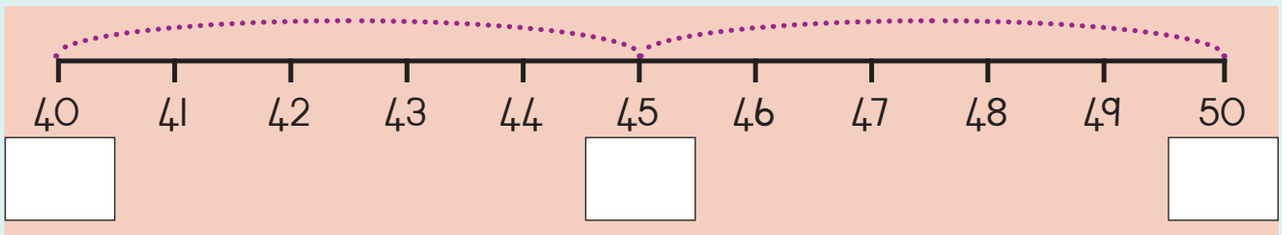

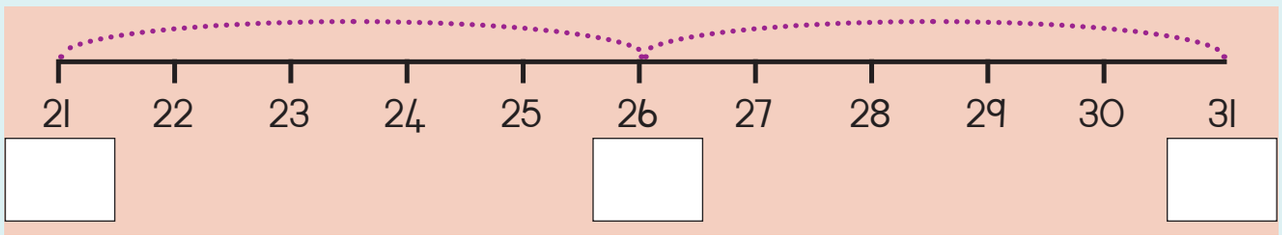

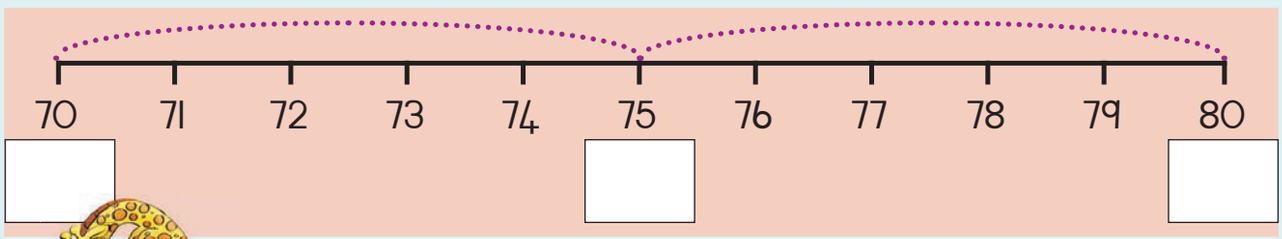

Qedela lokhu okulandelayo.

5, 10, 15, __, __, __	1, 6, 11, __, __, __	50, 45, 40, __, __, __
20, 25, 30, __, __, __	23, 28, 33, __, __, __	60, 55, 50, __, __, __
30, 35, 40, __, __, __	25, 20, 15, __, __, __	54, 49, 44, __, __, __

5 10 15 20 25 30 35 40 45 50

Teacher:
Sign:
Date:

11 12 13 14 15 16 17 18 19 20

57a

Usuku:

Imizuzu

1 Siyibiza ngani imigqa emincane emifushane esewashini?





Ake ucabange ukuthi ungenzani ngomzuzu owodwa

2 Gcwalisa ngemizuzu.

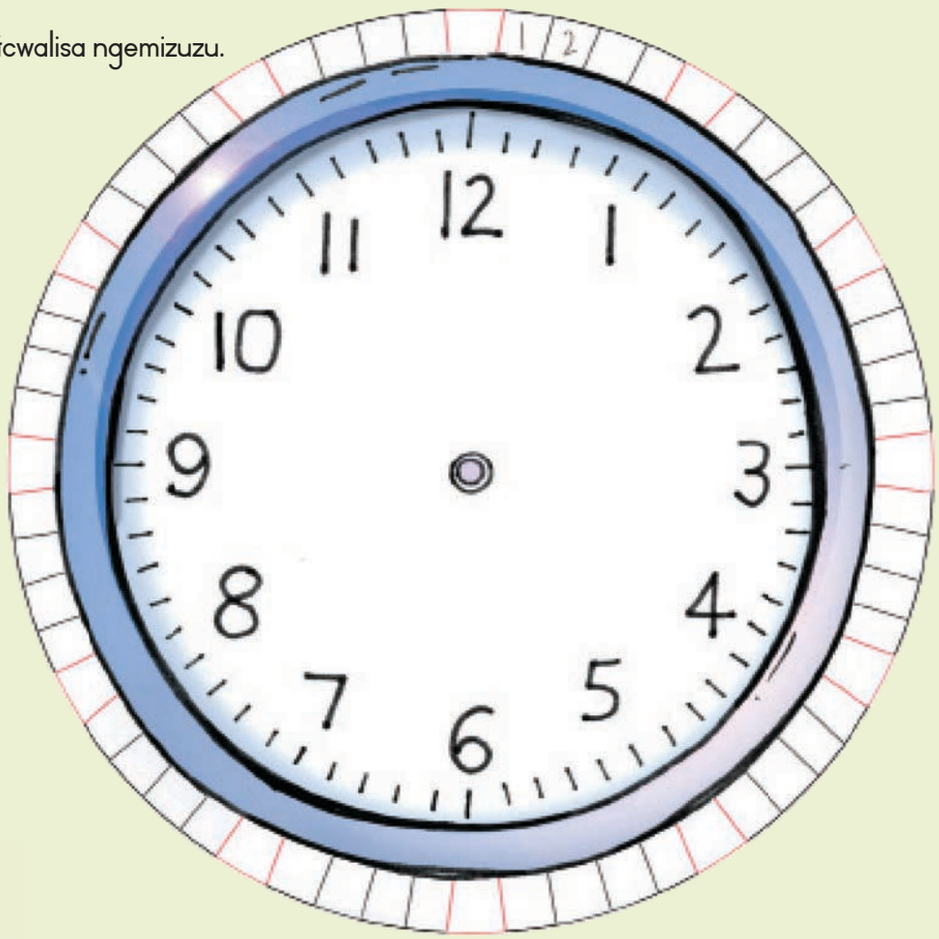

3 Bhala izinombolo ezisezikweleni ezibomvu.

1 2 3 4 5 6 7 8 9 10



Yenza umdwebo ngezinto ongazenza esikhathini esi ...

Umzuzu o-1	Imizuzu e-5
Imizuzu engama-30	Imizuzu engama-60

Teacher:
Sign:
Date:

11 12 13 14 15 16 17 18 19 20

57b

Usuku:

Imizuzu iyaqhutshwa

1 Khuluma ngewashi.



Uthi olude lukhombisa imizuzu.

Lapha lukhombisa imizuzu eyi-10.

Uthi lwewashi luyajikeleza, lujikeleze lujikeleze,
lujikeleze lujikeleze, lujikeleze lujikeleze
Uthi lwewashi luyajikeleza lujikeleze,
bese lusitshela isikhathi.

2 Lusikhombisani uthi olude?



imizuzu



imizuzu



imizuzu



imizuzu



imizuzu



imizuzu



Dweba uthi olude.

imizuzu engama-55



imizuzu engama-35



imizuzu engama-60



imizuzu eyi-10



imizuzu engama-45



imizuzu eyi-12



Yini ethatha umzuzu ukwenziwa? Faka umbala empendulweni efanele.



Ukudlala ingqathu



Ukudlala



Ukudla

Teacher:
Sign:
Date:

Usuku:

Ukwenza amaqoqo nokwahlukaniselana

1

Mangaki amabhulokhi esiyingini ngasinye? Hlukanisela abantwana.



2

Mangaki amabhulokhi esiyingini ngasinye? Bhala isamba esiyingini esisasibhakabhaka.

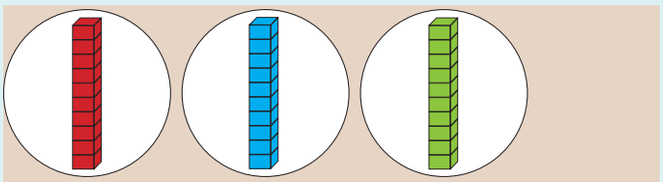

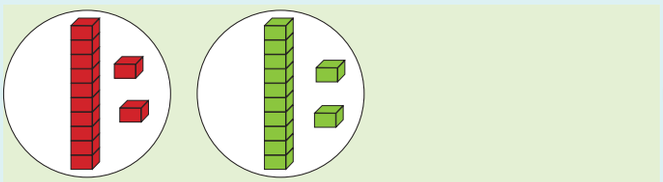

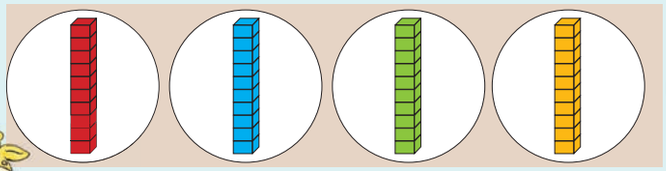

□ × □ = □

□ × □ = □

□ × □ = □

3

Hlukanisa amabhulokhi uwafake eziyingini.

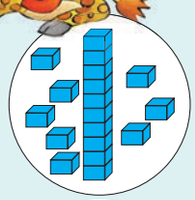





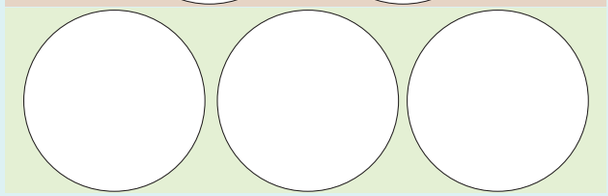

□ Hlukanisa phakathi □ = □

□ Hlukanisa phakathi □ = □



Dweba lokhu okulandelayo. Bhala lesi sibalo ngasinye.

amaqoqo a-3 anezinto ezi-2

+ Isibalo sokuhlanganisa:

× Isibalo sokuphindaphinda:

Amaqoqo amabili anokuyi-14

+ Isibalo sokuhlanganisa:

× Isibalo sokuphindaphinda:

Hlukanisela abantu aba-4 izibali eziyi-12.

− Isibalo sokususa:

÷ Hlukanisela abantu (isibalo sokuhlukanisa):

Hlukanisela abantu aba-3 izibali ezingama-30.

− Isibalo sokususa:

÷ Hlukanisela abantu (isibalo sokuhlukanisa):

Bala:

amaqoqo a-2 anezinto eziyi-7 _____
amaqoqo a-3 anezinto eziyi-8 _____
amaqoqo a-4 anezinto ezi-5 _____
amaqoqo a-2 anezinto eziyi-15 _____
Hlukanisela abantu aba-2 izinto eziyi-18 _____
Hlukanisela abantu aba-3 izinto ezingama-24 _____
Hlukanisela abantu aba-5 izinto ezingama-35 _____
Hlukanisela abantu aba-10 izinto ezingama-50 _____

Edilini lami bekunamaqembu a-6 abantu abebehamba ngaba-5. Bangaki abantu abebesedilini lami?

Teacher:
Sign:
Date:

11 12 13 14 15 16 17 18 19 20



Usuku:

Ukwenza amaqoqo nokuhlukaniselana kuyaqhutshwa

1 Zingaki izibali ezisesiyingini ngasinye? Zihlukanisele abantwana.



2 Zingaki izibali ezisesiyingini ngasinye? Bhala isamba sazo esiyingini esisasibhakabhaka.

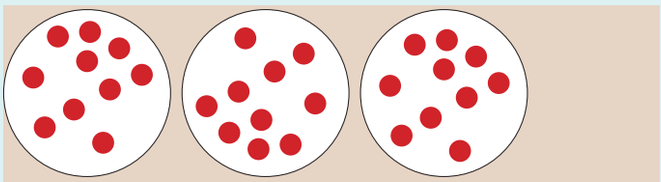

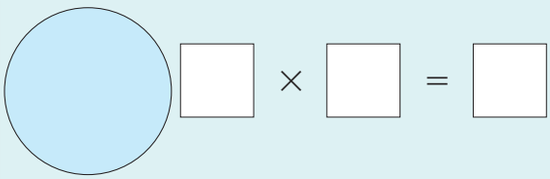



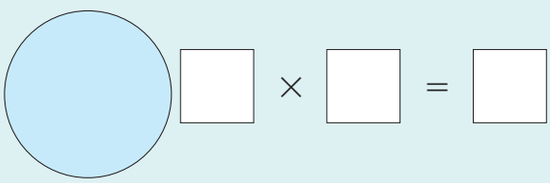

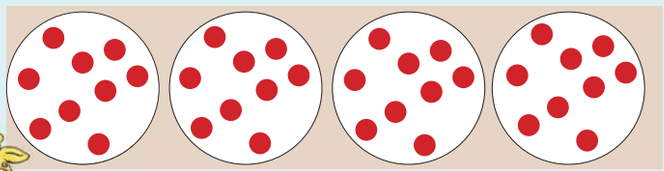

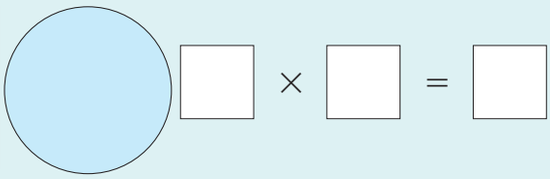

3 Hlukanisa izibali uzifake eziyingini.

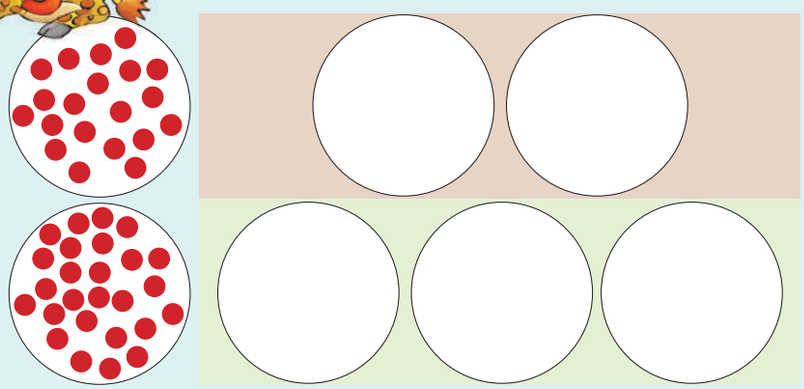

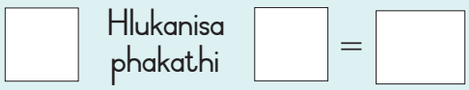

Hlukanisa phakathi



Hlukanisa phakathi





Dweba lokhu okulandelayo. Bhala lesi sibalo ngasinye.

amaqoqo a-3 anezinto eziyi-12

+ Isibalo sokuhlanganisa:

× Isibalo sokuphindaphinda:

amaqoqo a-5 anezinto eziyi-10

+ Isibalo sokuhlanganisa:

× Isibalo sokuphindaphinda:

Hlukanisela abantu aba-4 izibali ezingama-24.

− Isibalo sokususa:

÷ Hlukanisela abantu (isibalo sokuhlukanisa):

Hlukanisela abantu aba-5 izibali ezingama-25.

− Isibalo sokususa:

÷ Hlukanisela abantu (isibalo sokuhlukanisa):



Bala:

amaqoqo a-2 anezinto eziyi-11 _____

amaqoqo a-4 anezinto ezi-4 _____

Hlukanisela abantu aba-2 izinto ezingama-20 _____

Hlukanisela abantu aba-5 izinto ezingama-50 _____

amaqoqo a-3 anezinto eziyi-10 _____

amaqoqo a-2 anezinto ezingama-25 _____

Hlukanisela abantu aba-3 izinto ezingama-27 _____

Hlukanisela abantu aba-2 izinto ezingama-28 _____



phinda kabili hlukanisa

Teacher:

Sign:

Date:

11 12 13 14 15 16 17 18 19 20

60

Usuku:

Okunye futhi ngokwenza amaqoqo nokwahlukaniselana

Mangaki amabhulokhi esiyingini ngasinye? Hlukanisela izingane ezimbili.



Zingaki izibali ezisesiyingini ngasinye?

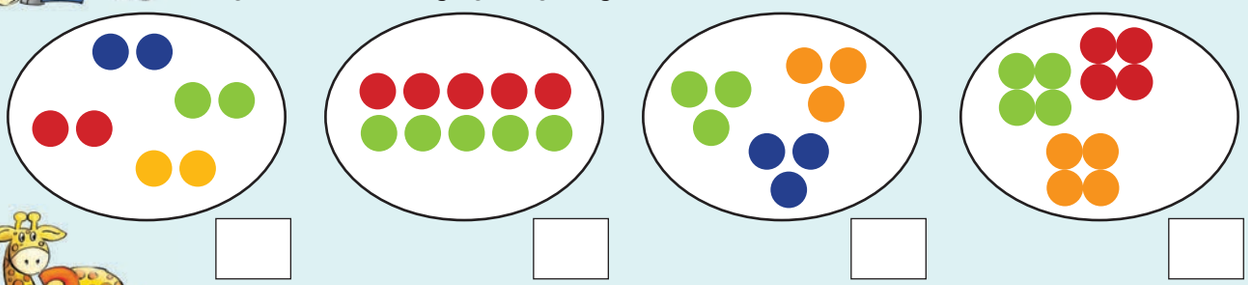

Sika izimo Kokusikwayo kwe-4 ukunamathisele ebhulokhini elifanele.
Bala izimo.

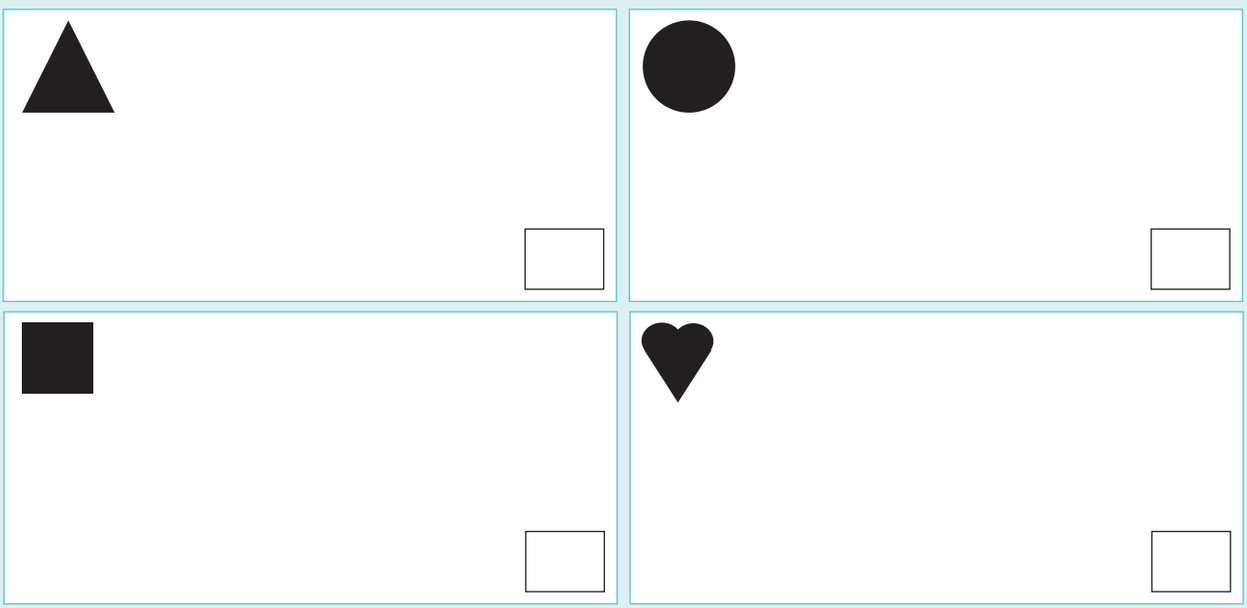





4 Hlukanisela izingane izimo. Sebenzisa izimo Kokusikwayo kwesi-4.
(Ikhasi lokusebenzela ingxenye 60)

onxantathu




izikwele






5 Hlukanisela abantwana izithelo. Kudwebe lokho.




amawolintshi




ama-aphula






6 OJona noBhelinda bahlukaniselane amaswidi ayi-12 ngokulinganayo.
Bathole amaswidi amangaki umuntu ngamunye?

Teacher:
Sign:
Date:

11 12 13 14 15 16 17 18 19 20

61

Usuku:

Siyaphinda ngokwakha amaqoqo nokwahlukaniselana

1 Bungaki ubuhlalu obusesiyingini ngasinye? Hlukanisela abantwana.



2 Hlukanisela abantu (isibalo sokuhlukanisa)?

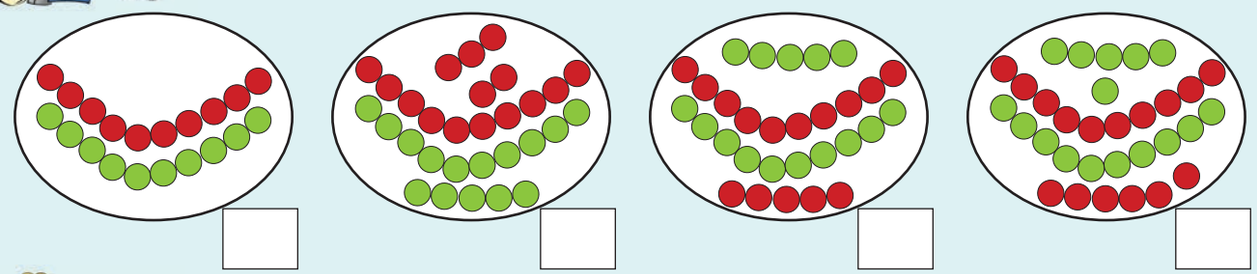

3 Sika ubuhlalu Kokusikwayo kwesi-4 (Ikhasi lokusebenzela ingxenye 61) ubunamathisele lapha. Bala lobu buhlalu.

Ubuhlalu obubomvu	Ubuhlalu obusasibhakabhaka
Ubuhlalu obuphuzi	Ubuhlalu obusatshani





4 Dweba ubuhlalu obulingana izingane ngayinye.






5 Hlukanisela izingane ubuhlalu. Budwebe.

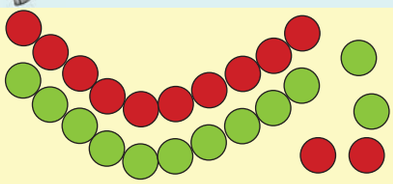
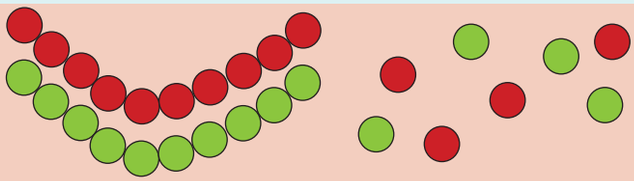







6 UBusi noZaheda bahlukaniselane ngokulinganayo amapensela enemibala angama-32. Bathole amapensela amangaki ngamunye?

Teacher:
Sign:
Date:

11 12 13 14 15 16 17 18 19 20

Usuku:

Ohhafu: 1 – 20

Kwenzekeni ngama-aphula?



1 Hlukanisa ama-aphula akwesokunxele uwafake kobhasikidi kwesokudla. Kudwebe lokhu.

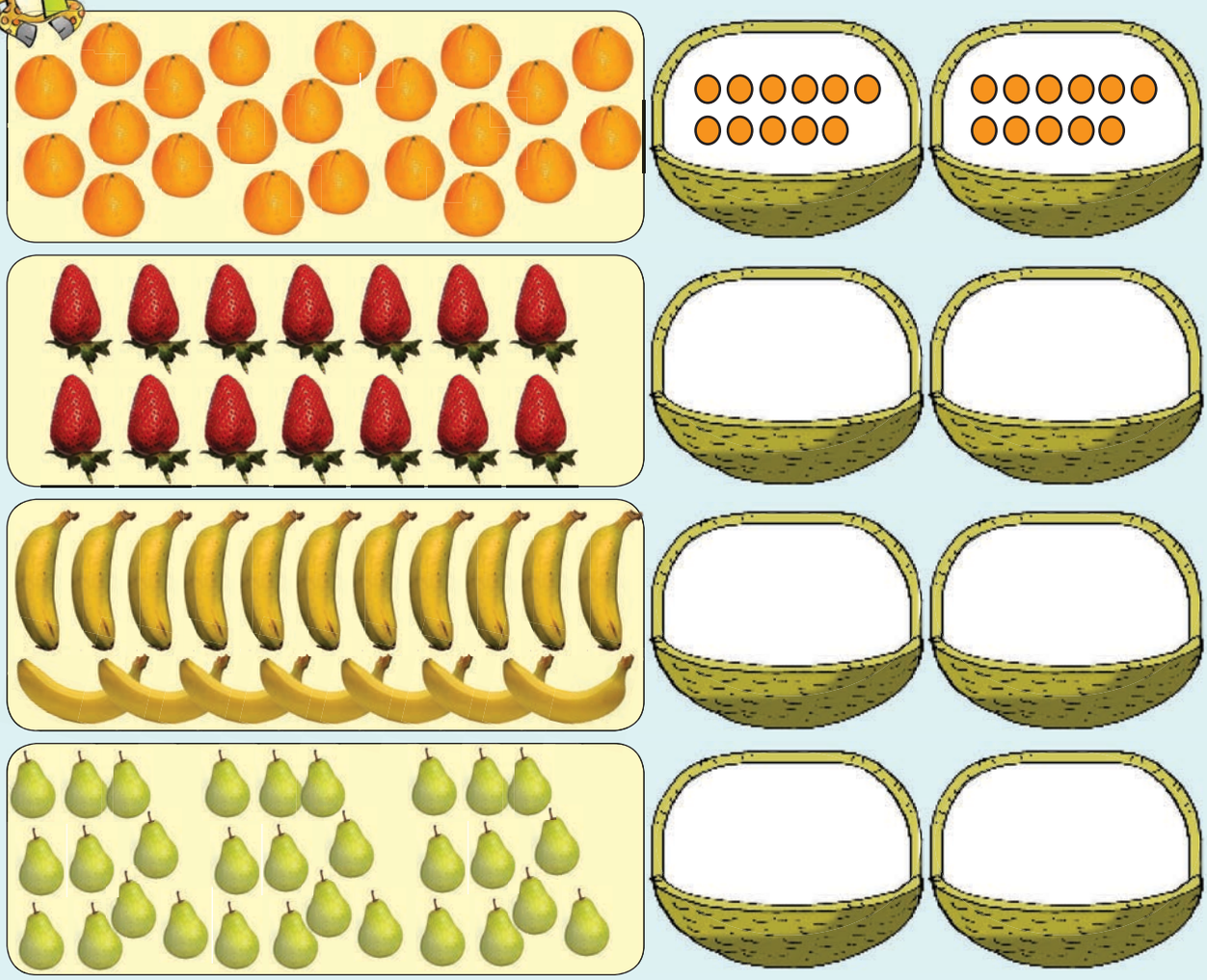



2 Dweba umugqa ukhombise uhhafu.

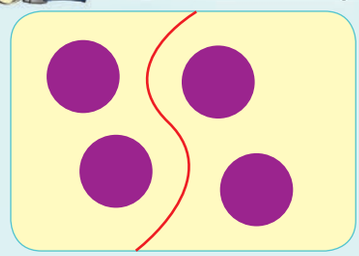

Uhhafu woku-4

2



Uhhafu wokuyi-6



Uhhafu wokuyi-8



Uhhafu woku-2

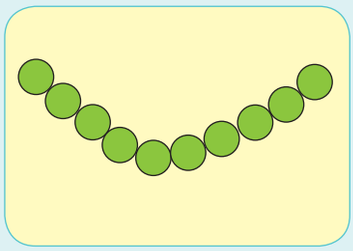

Uhhafu wokuyi-10

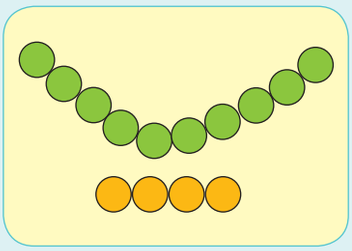

Uhhafu wokuyi-14

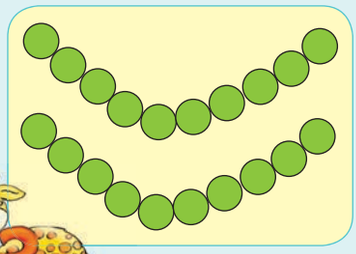

Uhhafu wokungama-20

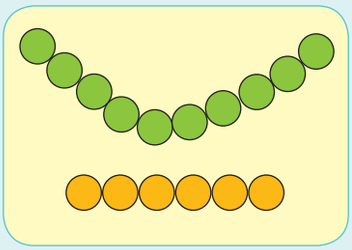

Uhhafu wokuyi-16

3 Ungakanani uhhafu wokudla okusepuletini?

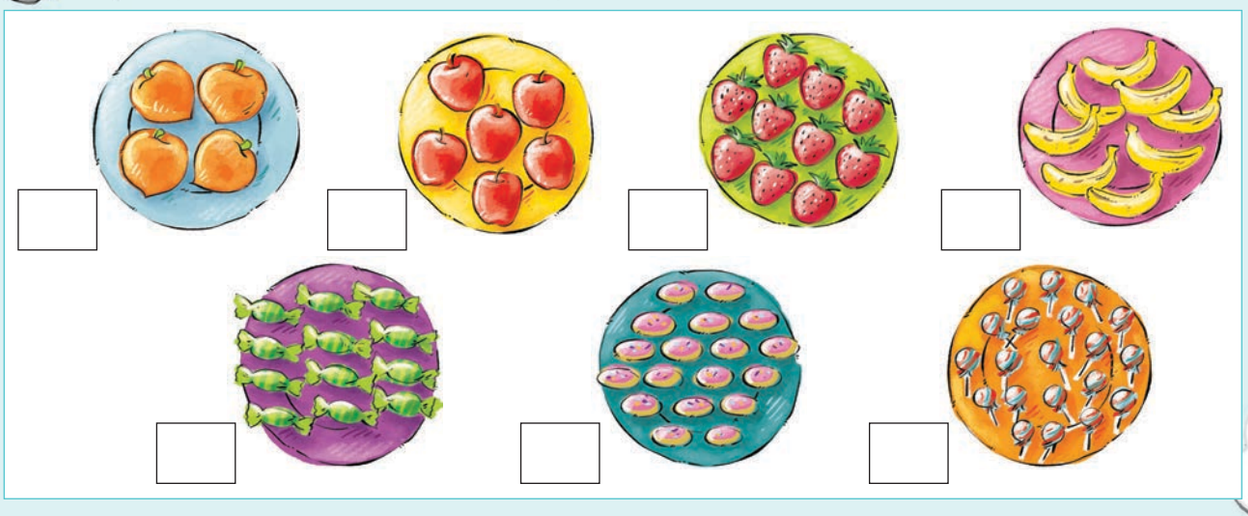

Teacher:

Sign:

Date:

11 12 13 14 15 16 17 18 19 20

63

Usuku:

Ukwahlukaniselana 20 – 50



Xoxela umngani wakho ukuthi ubuhlalu ubuhlukanisa kanjani ubufake ezitsheni ezimbili.







Hlukanisa ubuhlalu ngokulinganayo ubufake kobhasikidi ababili. Dweba ngenkathi ubufaka kobhasikidi.

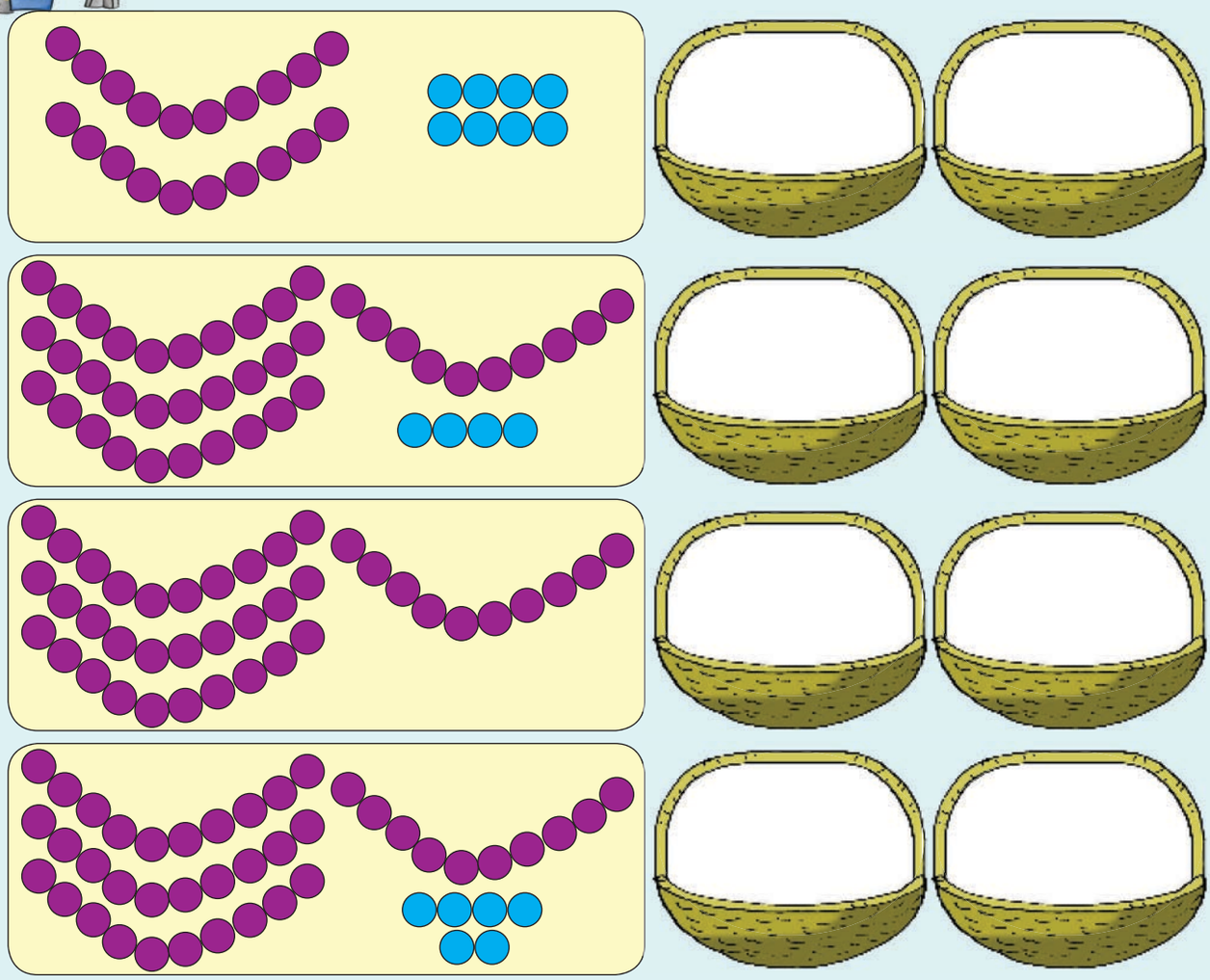





Faka umbala ohlukile kuhhafu owodwa.

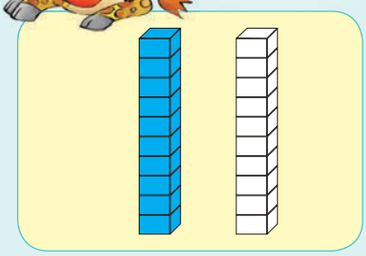

Uhhafu wokungama-20 ngoku- 10

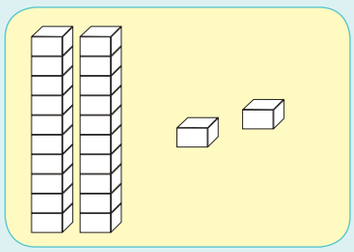

Uhhafu wokungama-22 ngoku- ☐

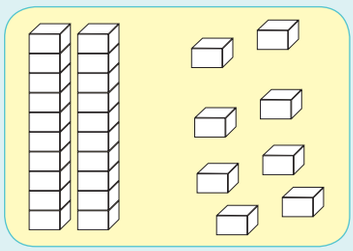

Uhhafu wokungama-28 ngoku- ☐

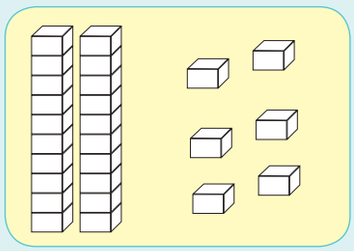

Uhhafu wokungama-26 ngoku- ☐

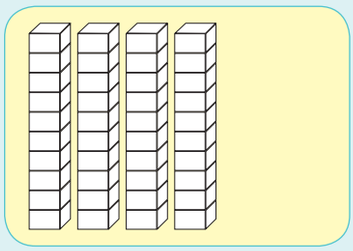

Uhhafu wokungama-40 ngoku- ☐

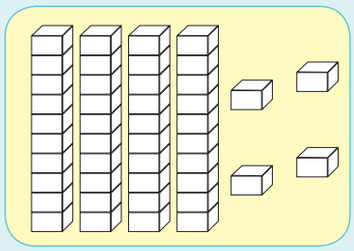

Uhhafu wokungama-44 ngoku- ☐

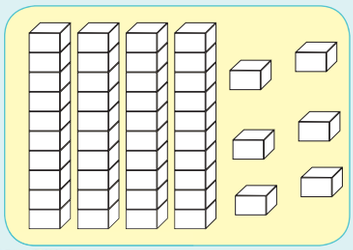

Uhhafu wokungama-46 ngoku- ☐

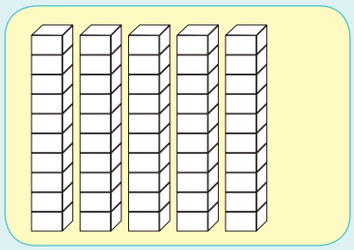

Uhhafu wokungama-50 ngoku- ☐



Faka umbala kuhhafu womdwebo.

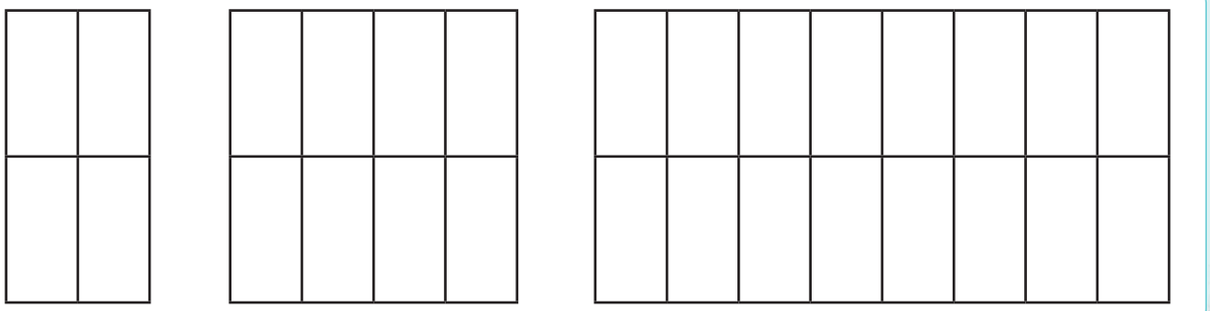

Teacher:
Sign:
Date:

11 12 13 14 15 16 17 18 19 20

Usuku:

Imininingwane



Hlela izithelo. Khombisa ngokwenza umdwebo. Bhala isamba sazo ebhokisini.



Ngiwahlele ngokubeka awuhlobo olufanayo ndawonye.

Dweba igrafu yezithombe yezithelo oqeda kuzihlela.



Buka izithelo bese uphendula imibuzo.



Yimaphi amaningi ngaphezu kwawo wonke?

Yimaphi ambalwa kunawo wonke?

Teacher:

Sign:

Date:

Okusikwayo koku-1

Ikhasi lokusebenzela 10 no- 40



Ikhasi lokusebenzela 13

Ekuseni kakhulu	Ntambama kakhulu	Ntambama
Ebusuku	Ebusuku kakhulu	Ekuseni namantambama

Okusikwayo kwesi-2

Ikhasi lokusebenzela 22

Imigubho yomlando kanye neminye ebalulekile

Usuku Lwamalungelo Abantu

Usuku Lokubuyisana

Usuku Lwabasebenzi

Usuku Lwentsha

Usuku Lwamasiko

Usuku Lwabesifazane

Usuku Lwenkululeko

Izimpawu zezenkolo



OlweBahai | OlweJudaic | OlweBud-dhist | Olwe-Islamic | OlobuKre-stu | Olwabom-dabu base-Afrika | OlwesiHindu

Cut-out 3

Worksheets 25 and 26



R50	R50	R50	R50	R50
R10	R10	R10	R10	R10
R20	R20	R20	R20	R20
R100	R100	R100	R100	R100
R50	R50	R50	R50	R50
R10	R10	R10	R10	R10
R20	R20	R20	R20	R20
R100	R100	R100	R100	R100

ENG MAT G2 B1 cut-outs.indd 142 2014/04/28 9:37 PM

Cut-out 4

Worksheet 27



Worksheet 60





Worksheet 61

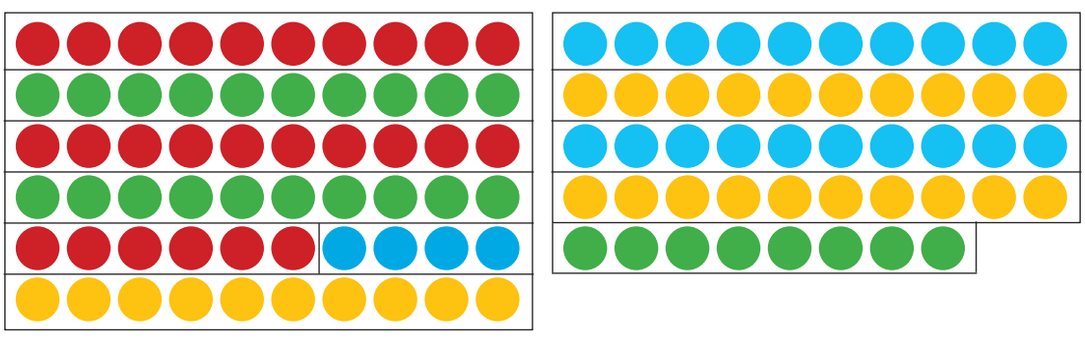

ENG MAT G2 B1 cut-outs.indd 144 2014/04/28 9:37 PM